Identifizieren der Menge mit 100 Blöcken

Name:

Verwenden Sie die Blöcke, um die Gesamtmengen zu bestimmen.

Bsp) 

3 hunderten = 30 zehnern = 300 einern

1) 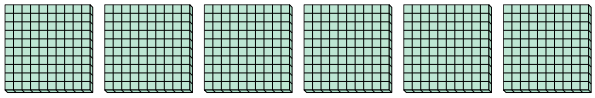

_____ hunderten = _____ zehnern = _____ einern

2) 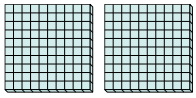

_____ hunderten = _____ zehnern = _____ einern

3) 

_____ hunderten = _____ zehnern = _____ einern

4) 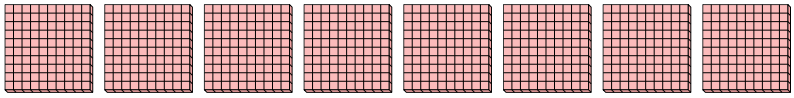

_____ hunderten = _____ zehnern = _____ einern

5) 

_____ hunderten = _____ zehnern = _____ einern

6) 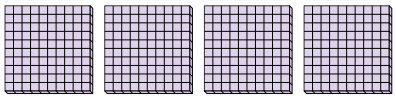

_____ hunderten = _____ zehnern = _____ einern

7) 

_____ hunderten = _____ zehnern = _____ einern

8)

_____ hunderten = _____ zehnern = _____ einern

Antworten

Bsp.	3	30	300
1.			
2.			
3.			
4.			
5.			
6.			
7.			
8.			

1-8	88	75	63	50	38	25	13	0

Identifizieren der Menge mit 100 Blöcken

Name: **Lösungsschlüssel**

Verwenden Sie die Blöcke, um die Gesamtmengen zu bestimmen.

Bsp)



3 hunderten = 30 zehnern = 300 einern

1)

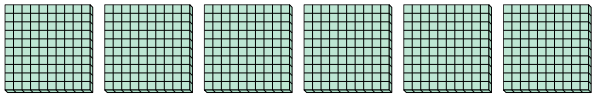

6 hunderten = 60 zehnern = 600 einern

2)

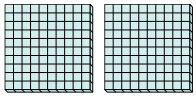

2 hunderten = 20 zehnern = 200 einern

3)



9 hunderten = 90 zehnern = 900 einern

4)

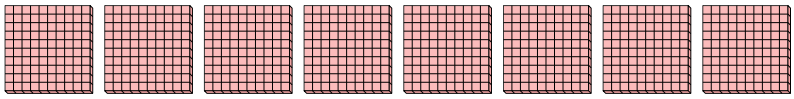

8 hunderten = 80 zehnern = 800 einern

5)



1 hunderten = 10 zehnern = 100 einern

6)

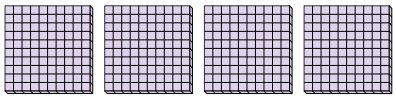

4 hunderten = 40 zehnern = 400 einern

7)



7 hunderten = 70 zehnern = 700 einern

8)

5 hunderten = 50 zehnern = 500 einern

Antworten

Bsp.	3	30	300
1.	6	60	600
2.	2	20	200
3.	9	90	900
4.	8	80	800
5.	1	10	100
6.	4	40	400
7.	7	70	700
8.	5	50	500

1-8	88	75	63	50	38	25	13	0