Uhren erstellen Name:

Zeichne den Stunden- und den Minutenzeiger auf die Uhr, sodass er die angezeigte Zeit darstellt.

1) 3:30

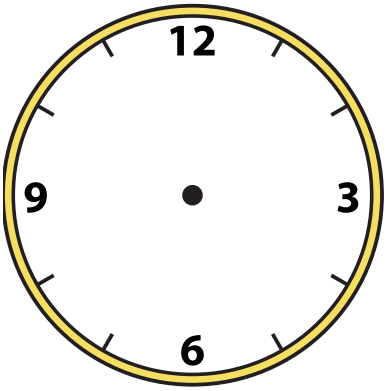

2) 5:45

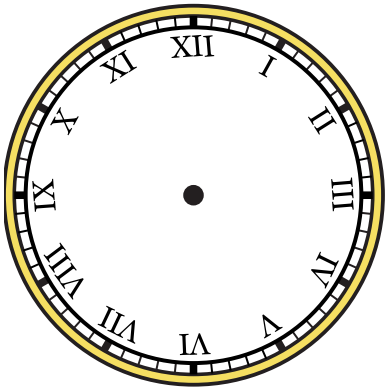

3) 3:25

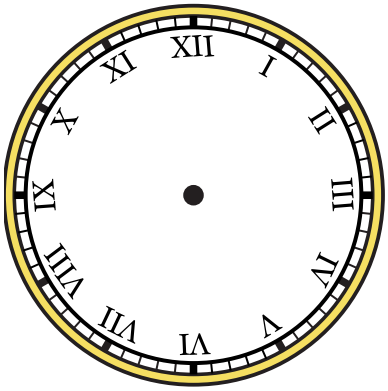

4) 7:10



5) 12:40

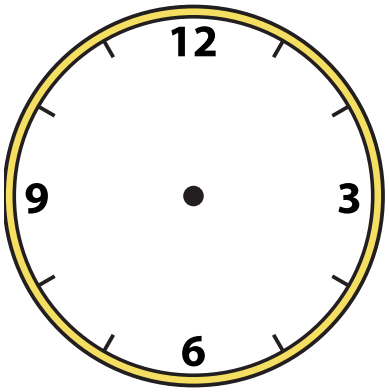

6) 4:35

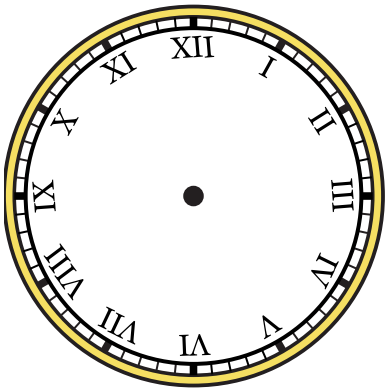

7) 5:20



8) 12:50



9) 6:55

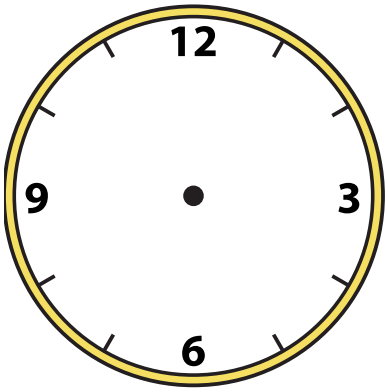

1-9	89	78	67	56	44	33	22	11	0

Uhren erstellen

Name: **Lösungsschlüssel**

Zeichne den Stunden- und den Minutenzeiger auf die Uhr, sodass er die angezeigte Zeit darstellt.

1) 3:30



2) 5:45

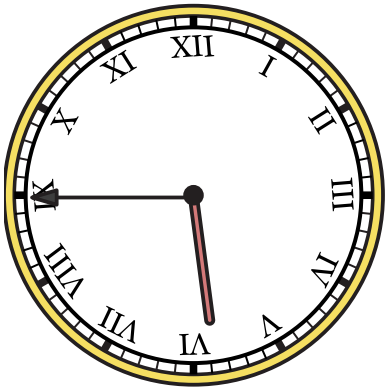

3) 3:25



4) 7:10

5) 12:40



6) 4:35



7) 5:20

8) 12:50

9) 6:55



1-9	89	78	67	56	44	33	22	11	0