Symmetrie bestimmen

Name:

Bestimme, ob die Linie durch jede Figur eine symmetrische Linie ist.

Bsp)

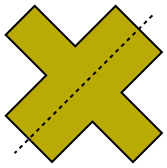

1)

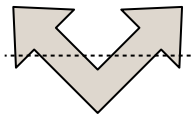

2)

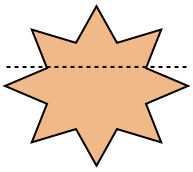

3)

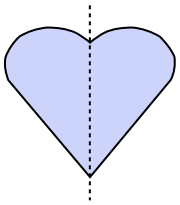

4)

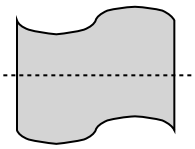

5)

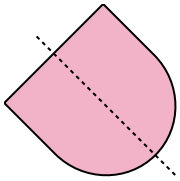

6)

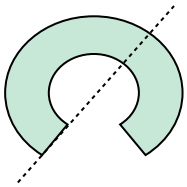

7)

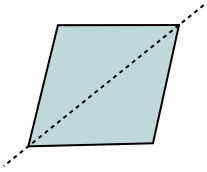

8)

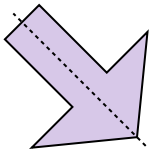

9)

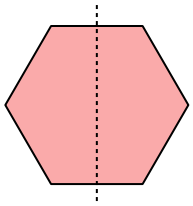

10)

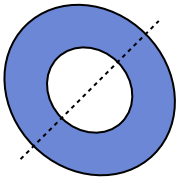

11)

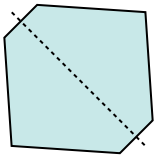

Antworten

Bsp. ja

1. _____

2. _____

3. _____

4. _____

5. _____

6. _____

7. _____

8. _____

9. _____

10. _____

11. _____

1-10	91	82	73	64	55	45	36	27	18	9
11	0									

Symmetrie bestimmen

Name: **Lösungsschlüssel**

Bestimme, ob die Linie durch jede Figur eine symmetrische Linie ist.

Bsp)

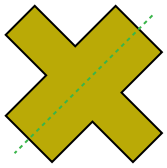

1)

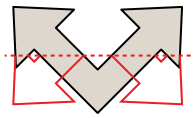

2)

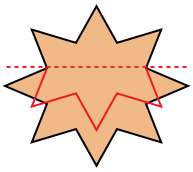

3)

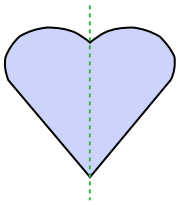

4)

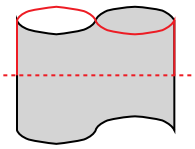

5)

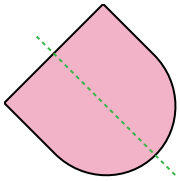

6)

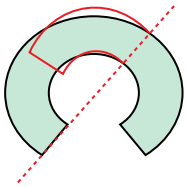

7)

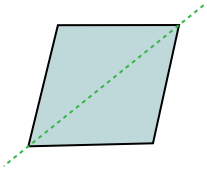

8)

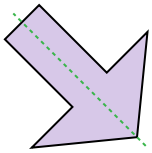

9)

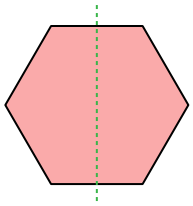

10)

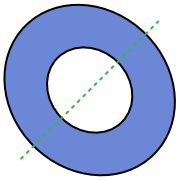

11)

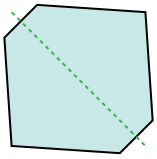

Antworten

Bsp.	ja
1.	no
2.	no
3.	ja
4.	no
5.	ja
6.	no
7.	ja
8.	ja
9.	ja
10.	ja
11.	ja

1-10	91	82	73	64	55	45	36	27	18	9
11	0									