Identifizieren von Dreieckstypen

Name:

Bestimmen Sie, ob jedes Dreieck spitz (A), stumpf (O) oder rechts (R) ist und ob es gleichseitig (E), gleichschenklig (I) oder skalenförmig (S) ist.

Acute Triangle:
All angles are less than 90°.

Obtuse Triangle:
One angle is greater than 90°.

Right Triangle:
One angle is 90°.

Equilateral Triangle:
3 equal sides. 3 equal angles.

Isosceles Triangle:
2 equal sides. 2 equal angles.

Scalene Triangle:
No equal sides. No equal angles.

1)

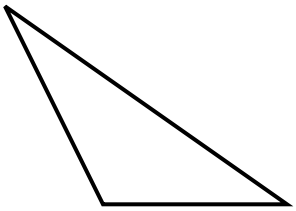

2)

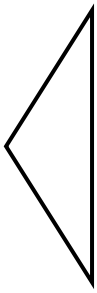

3)

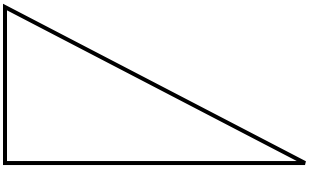

4)

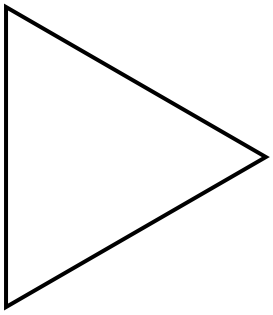

5)

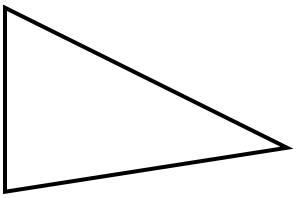

6)

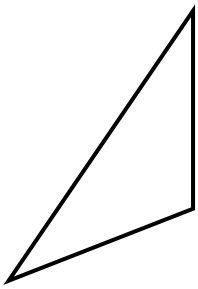

7)



8)

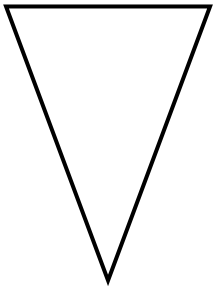

Antworten

1. _____
2. _____
3. _____
4. _____
5. _____
6. _____
7. _____
8. _____

1-8	88	75	63	50	38	25	13	0

Identifizieren von Dreieckstypen Name: **Lösungsschlüssel**

Bestimmen Sie, ob jedes Dreieck spitz (A), stumpf (O) oder rechts (R) ist und ob es gleichseitig (E), gleichschenklig (I) oder skalenförmig (S) ist.

Acute Triangle:
All angles are less than 90°.

Obtuse Triangle:
One angle is greater than 90°.

Right Triangle:
One angle is 90°.

Equilateral Triangle:
3 equal sides. 3 equal angles.

Isosceles Triangle:
2 equal sides. 2 equal angles.

Scalene Triangle:
No equal sides. No equal angles.

1)

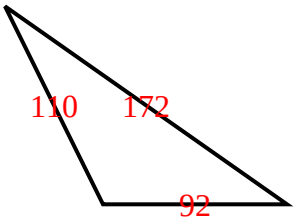

2)

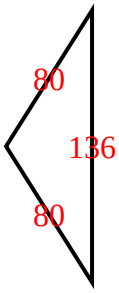

3)

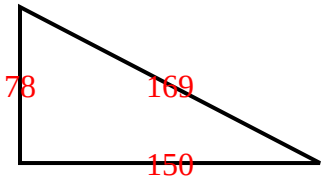

4)

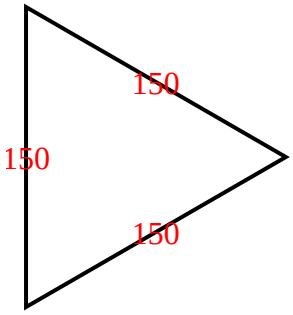

5)

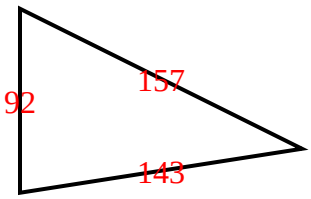

6)

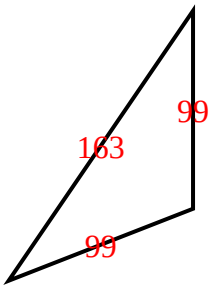

7)

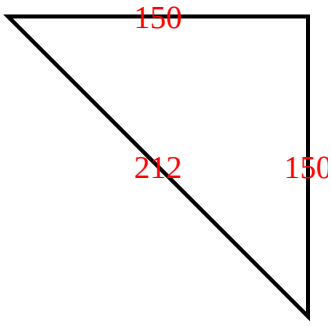

8)

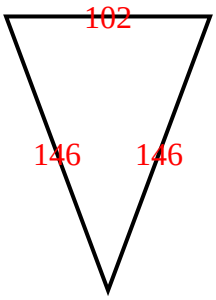

Antworten

1. O S
2. O I
3. R S
4. A E
5. A S
6. O I
7. R I
8. A I

1-8	88	75	63	50	38	25	13	0