Unregelmäßige Formen identifizieren

Name:

Identifiziere jede gezeigte Form.

1)

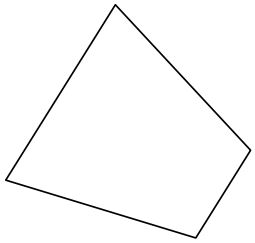

2)

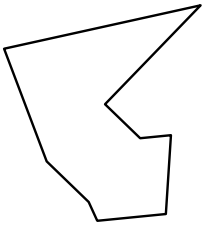

3)

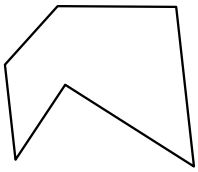

4)



5)



6)

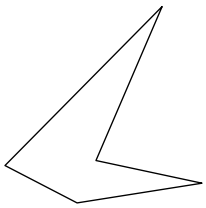

7)

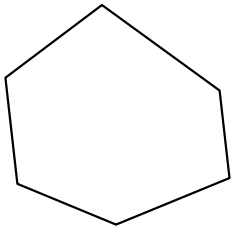

8)

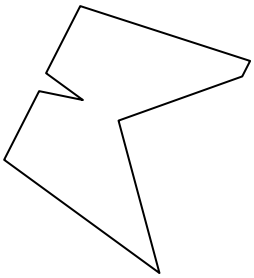

9)

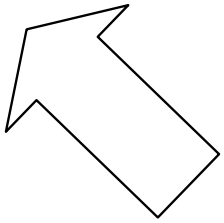

10)

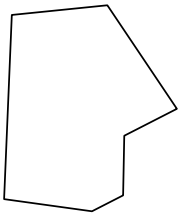

11)

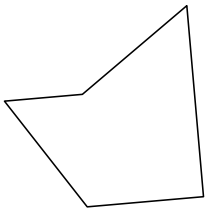

12)

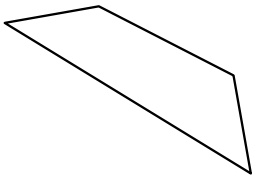

13)

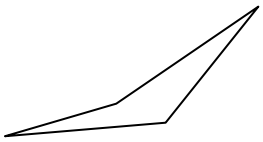

14)

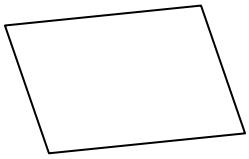

15)



16)

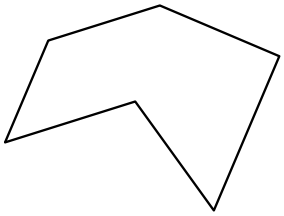

17)

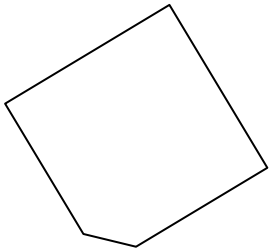

18)

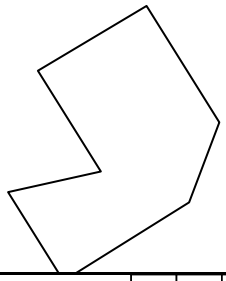

Antworten

1. _____
2. _____
3. _____
4. _____
5. _____
6. _____
7. _____
8. _____
9. _____
10. _____
11. _____
12. _____
13. _____
14. _____
15. _____
16. _____
17. _____
18. _____
19. _____
20. _____
21.

1-10	93	87	80	73	67	60	53	47	40	33
11-15	27	20	13	7	0					

Unregelmäßige Formen identifizieren

Name: **Lösungsschlüssel**

Identifiziere jede gezeigte Form.

1)

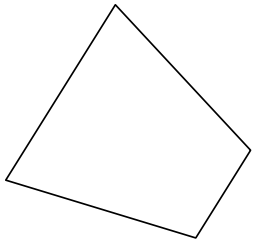

2)

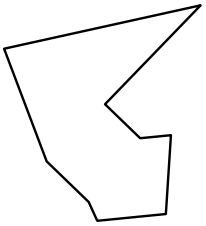

3)

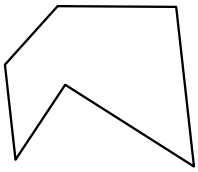

4)



5)



6)

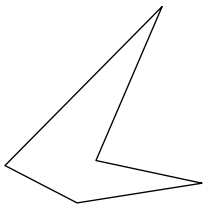

7)

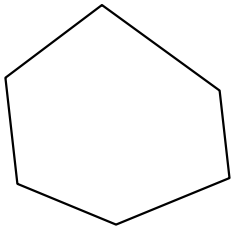

8)

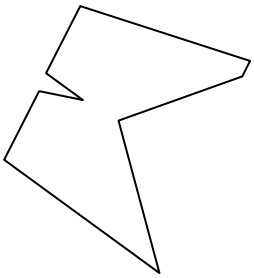

9)

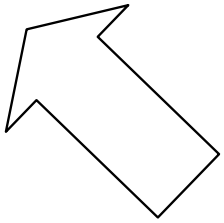

10)

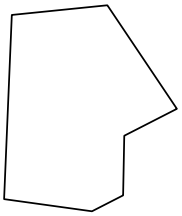

11)

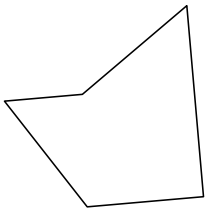

12)

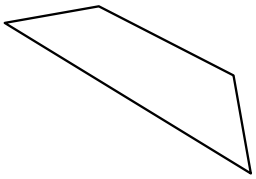

13)

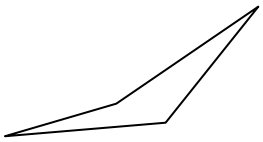

14)

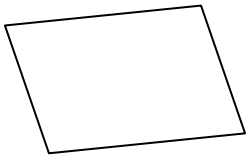

15)



16)

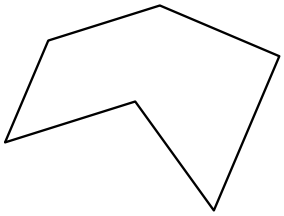

17)

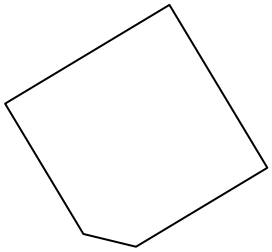

18)

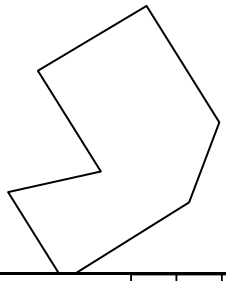

Antworten

1. Viereck
2. Neuneck
3. Sechseck
4. Fünfeck
5. Zehneck
6. Fünfeck
7. Sechseck
8. Neuneck
9. Siebeneck
10. Siebeneck
11. Fünfeck
12. Viereck
13. Viereck
14. Viereck
15. Siebeneck
16. Sechseck
17. Fünfeck
18. Siebeneck
19. Siebeneck
20. Achteck
21. Sechseck

1-10	93	87	80	73	67	60	53	47	40	33
11-15	27	20	13	7	0					