Unregelmäßige Formen identifizieren

Name:

Identifiziere jede gezeigte Form.

1)

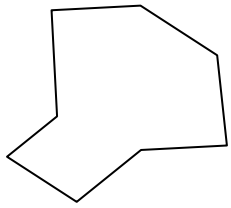

2)

3)

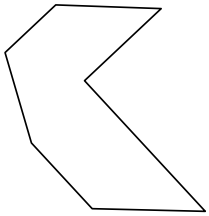

4)



5)

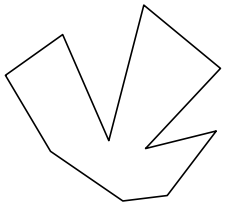

6)

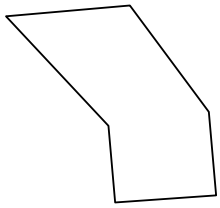

7)

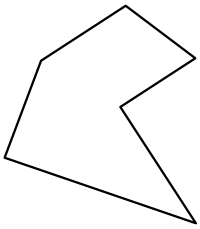

8)



9)

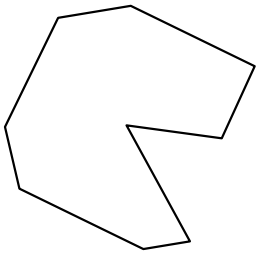

10)

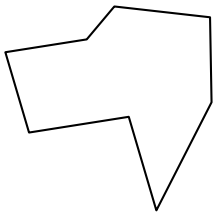

11)

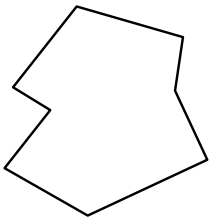

12)

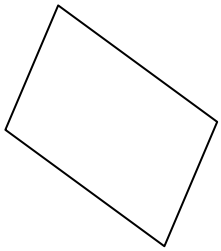

13)

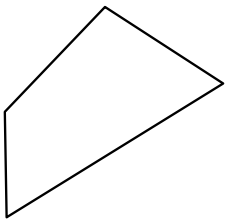

14)

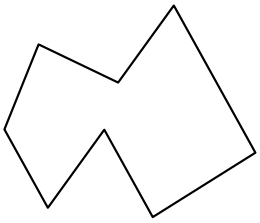

15)



16)

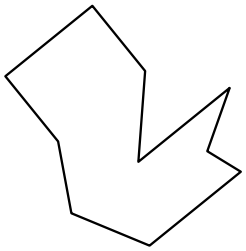

17)



18)

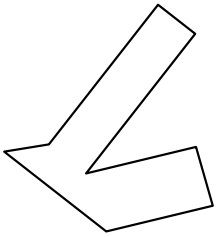

Antworten

1. _____
2. _____
3. _____
4. _____
5. _____
6. _____
7. _____
8. _____
9. _____
10. _____
11. _____
12. _____
13. _____
14. _____
15. _____
16. _____
17. _____
18. _____
19. _____
20. _____
21.

1-10	93	87	80	73	67	60	53	47	40	33
11-15	27	20	13	7	0					

Unregelmäßige Formen identifizieren

Name: **Lösungsschlüssel**

Identifiziere jede gezeigte Form.

1)

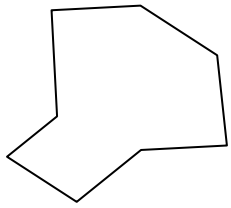

2)

3)

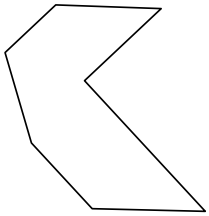

4)



5)

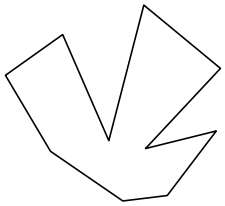

6)

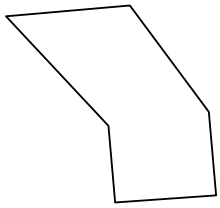

7)

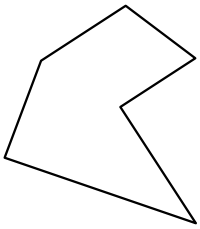

8)



9)

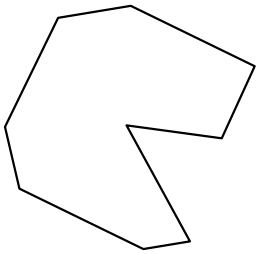

10)

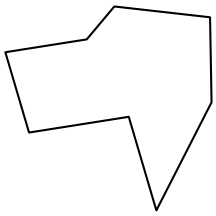

11)

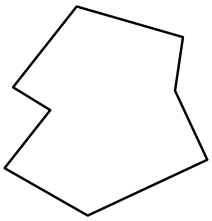

12)

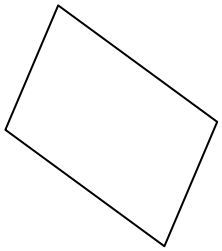

13)

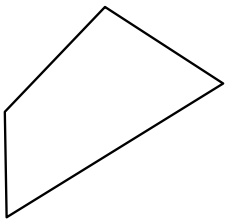

14)

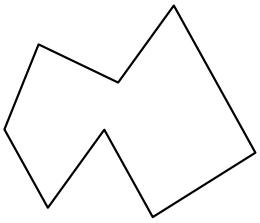

15)



16)

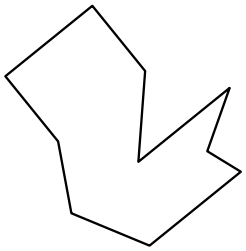

17)



18)

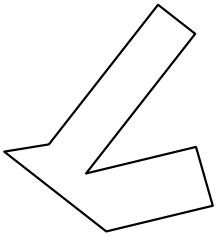

Antworten

1. Achteck
2. Viereck
3. Siebeneck
4. Zehneck
5. Zehneck
6. Sechseck
7. Sechseck
8. Fünfeck
9. Neuneck
10. Achteck
11. Achteck
12. Viereck
13. Viereck
14. Achteck
15. Neuneck
16. Zehneck
17. Achteck
18. Achteck
19. Viereck
20. Siebeneck
21. Neuneck

1-10	93	87	80	73	67	60	53	47	40	33
11-15	27	20	13	7	0					