Formen identifizieren Name:

**Stelle fest, was die gezeigten Formen sind: Dreieck, Quadrat, Rechteck, Sechseck oder eine andere Figur.**

**1)**

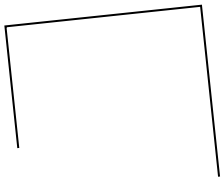

**2)**

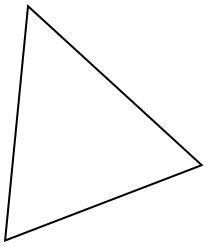

**3)**

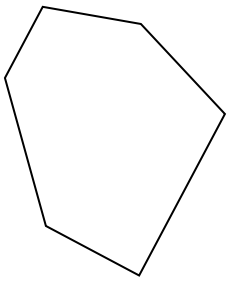

**4)**

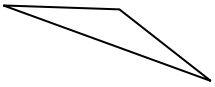

**5)**

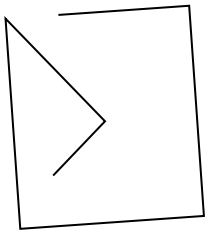

**6)**



**7)**

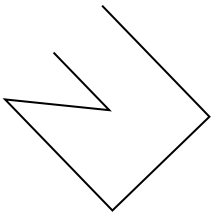

**8)**



**9)**

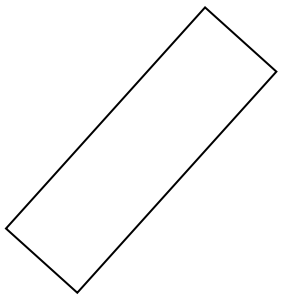

**10)**

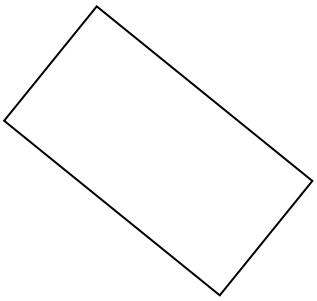

**11)**

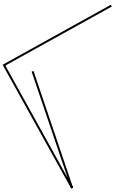

**12)**



**13)**

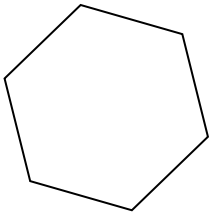

**14)**

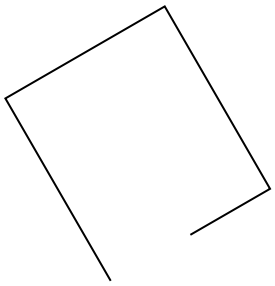

**15)**

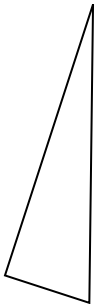

## Antworten

1. _____
2. _____
3. _____
4. _____
5. _____
6. _____
7. _____
8. _____
9. _____
10. _____
11. _____
12. _____
13. _____
14. _____
15. _____



| | | | | | | | | | | |
|---|---|---|---|---|---|---|---|---|---|---|
| 1-10 | 93 | 87 | 80 | 73 | 67 | 60 | 53 | 47 | 40 | 33 |
| 11-15 | 27 | 20 | 13 | 7 | 0 | | | | | |

Formen identifizieren

Name: **Lösungsschlüssel**

**Stelle fest, was die gezeigten Formen sind: Dreieck, Quadrat, Rechteck, Sechseck oder eine andere Figur.**

**1)**

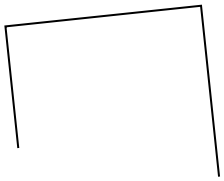

**2)**

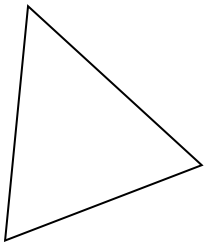

**3)**

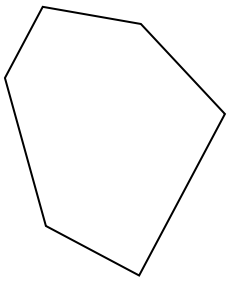

**4)**

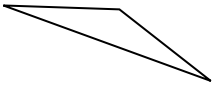

**5)**

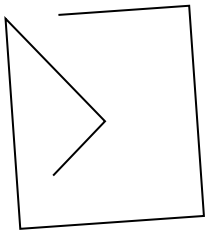

**6)**



**7)**

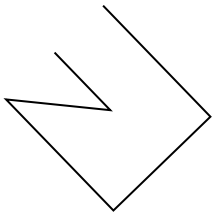

**8)**



**9)**

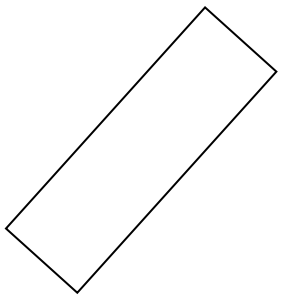

**10)**

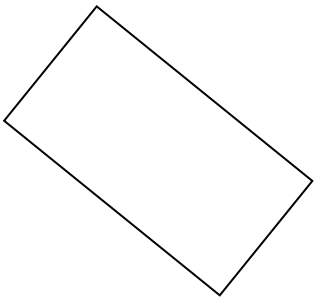

**11)**

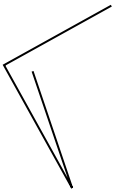

**12)**



**13)**

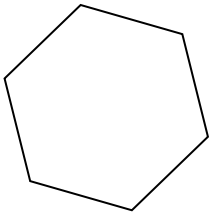

**14)**

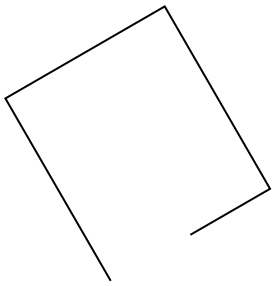

**15)**

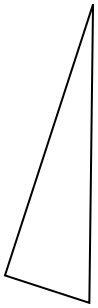

## Antworten

1. andere
2. triangle
3. Sechseck
4. triangle
5. andere
6. Sechseck
7. andere
8. square
9. rectangle
10. rectangle
11. andere
12. andere
13. Sechseck
14. andere
15. triangle



| | | | | | | | | | | |
|---|---|---|---|---|---|---|---|---|---|---|
| 1-10 | 93 | 87 | 80 | 73 | 67 | 60 | 53 | 47 | 40 | 33 |
| 11-15 | 27 | 20 | 13 | 7 | 0 | | | | | |