Runden auf 10er (mit Zahlenstrahl) Name:

Benutze den Zahlenstrahl um jede Zahl auf die nächste Zehnerstelle zu runden.

Bsp) 60

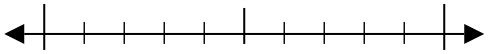

1) 72

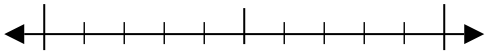

2) 23

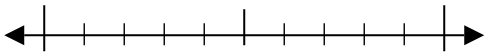

3) 63

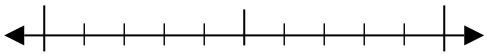

4) 377

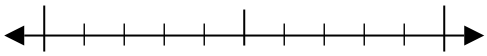

5) 223

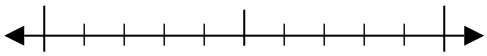

6) 916

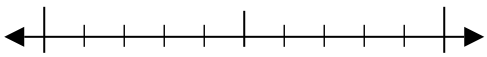

7) 341

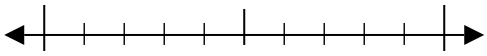

8) 3.935

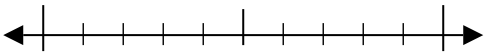

9) 8.922

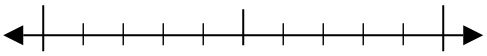

Antworten

Bsp. 60

1. _____
2. _____
3. _____
4. _____
5. _____
6. _____
7. _____
8. _____
9. _____

1-9	89	78	67	56	44	33	22	11	0

Runden auf 10er (mit Zahlenstrahl) Name: **Lösungsschlüssel**

Benutze den Zahlenstrahl um jede Zahl auf die nächste Zehnerstelle zu runden.

Bsp) 60

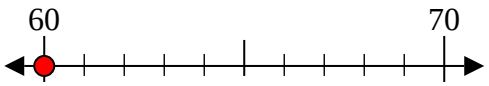

1) 72

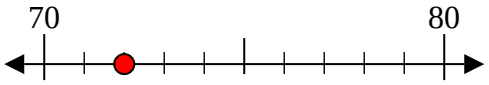

2) 23

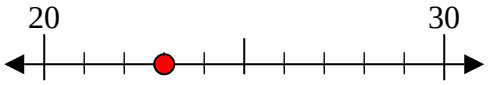

3) 63

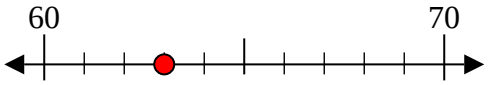

4) 377

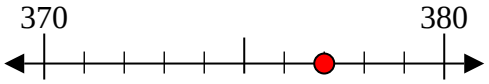

5) 223

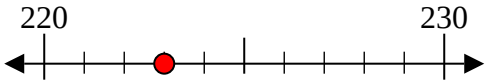

6) 916

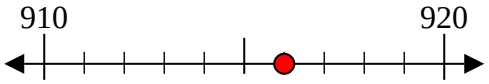

7) 341

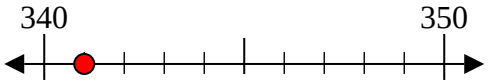

8) 3.935

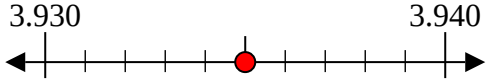

9) 8.922

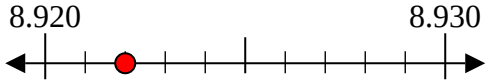

Antworten

Bsp.	60
1.	70
2.	20
3.	60
4.	380
5.	220
6.	920
7.	340
8.	3940
9.	8920

1-9	89	78	67	56	44	33	22	11	0

Runden auf 10er (mit Zahlenstrahl) Name:

Benutze den Zahlenstrahl um jede Zahl auf die nächste Zehnerstelle zu runden.

Bsp) 76

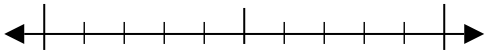

1) 81

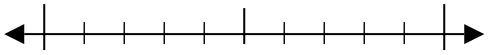

2) 40

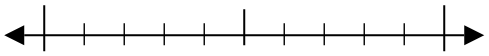

3) 86

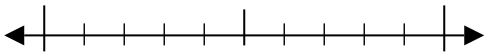

4) 916

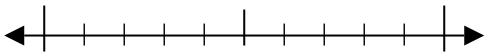

5) 460

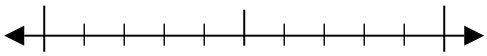

6) 576

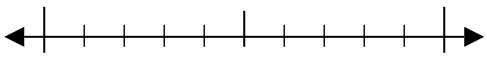

7) 425

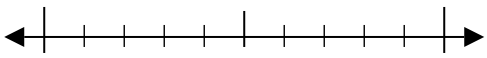

8) 6.669

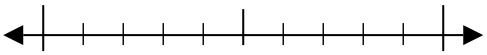

9) 7.299

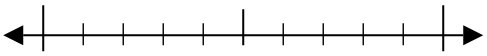

Antworten

Bsp. 80

1. _____
2. _____
3. _____
4. _____
5. _____
6. _____
7. _____
8. _____
9. _____

1-9	89	78	67	56	44	33	22	11	0

Runden auf 10er (mit Zahlenstrahl) Name: **Lösungsschlüssel**

Benutze den Zahlenstrahl um jede Zahl auf die nächste Zehnerstelle zu runden.

Bsp)

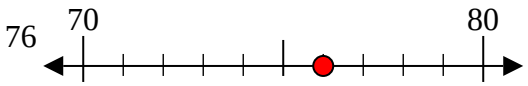

1)

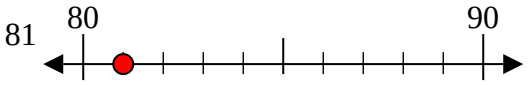

2)

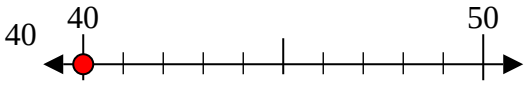

3)

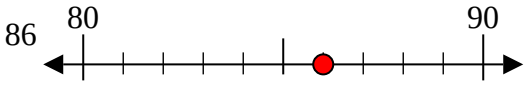

4)

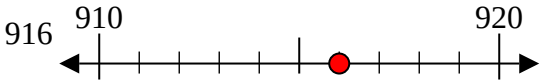

5)

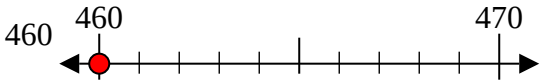

6)

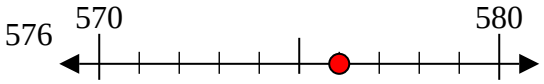

7)

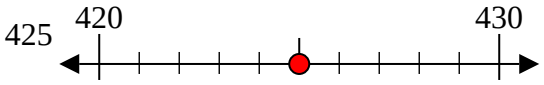

8)

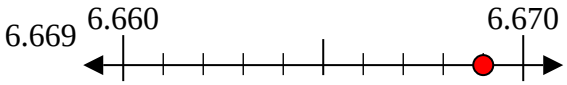

9)

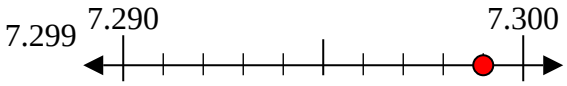

Antworten

Bsp.	80
1.	80
2.	40
3.	90
4.	920
5.	460
6.	580
7.	430
8.	6670
9.	7300

1-9	89	78	67	56	44	33	22	11	0

Runden auf 10er (mit Zahlenstrahl) Name:

Benutze den Zahlenstrahl um jede Zahl auf die nächste Zehnerstelle zu runden.

Bsp) 91

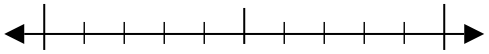

1) 77

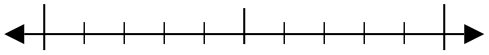

2) 98

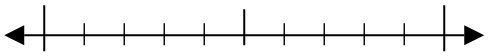

3) 39

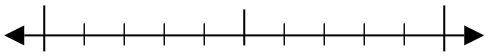

4) 499

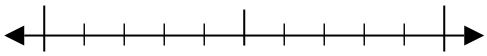

5) 890

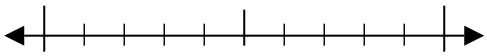

6) 466

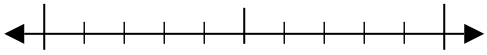

7) 373

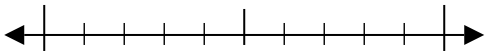

8) 9.478

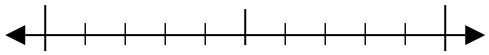

9) 7.699

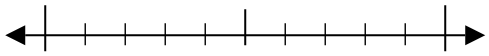

Antworten

Bsp. **90**

1. _____
2. _____
3. _____
4. _____
5. _____
6. _____
7. _____
8. _____
9. _____

1-9	89	78	67	56	44	33	22	11	0

Runden auf 10er (mit Zahlenstrahl) Name: **Lösungsschlüssel**

Benutze den Zahlenstrahl um jede Zahl auf die nächste Zehnerstelle zu runden.

Bsp)

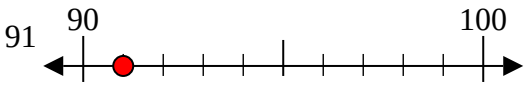

1)

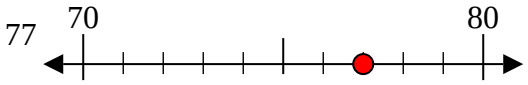

2)

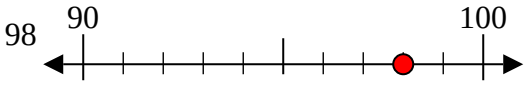

3)

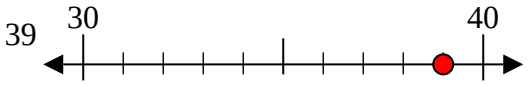

4)

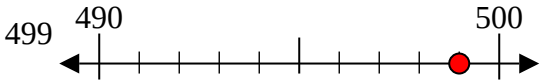

5)

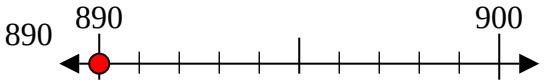

6)

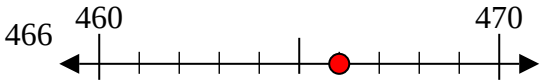

7)

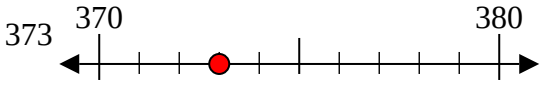

8)

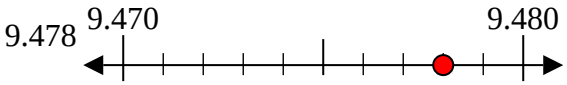

9)

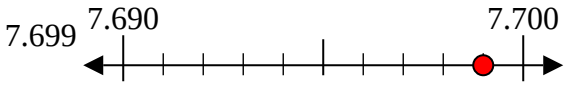

Antworten

Bsp.	90
1.	80
2.	100
3.	40
4.	500
5.	890
6.	470
7.	370
8.	9480
9.	7700

1-9	89	78	67	56	44	33	22	11	0

Runden auf 10er (mit Zahlenstrahl) Name:

Benutze den Zahlenstrahl um jede Zahl auf die nächste Zehnerstelle zu runden.

Bsp) 97

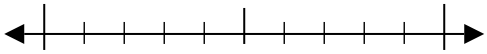

1) 29

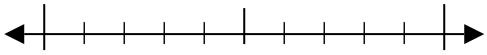

2) 63

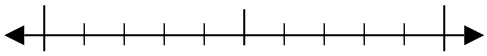

3) 43

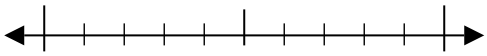

4) 697

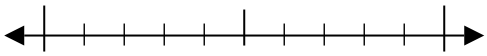

5) 810

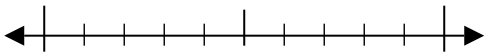

6) 880

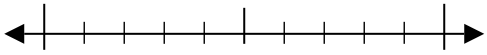

7) 924

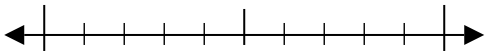

8) 9.310

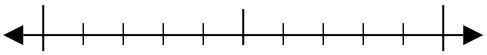

9) 8.192

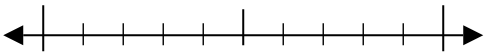

Antworten

Bsp. **100**

1. _____
2. _____
3. _____
4. _____
5. _____
6. _____
7. _____
8. _____
9. _____

1-9	89	78	67	56	44	33	22	11	0

Runden auf 10er (mit Zahlenstrahl) Name: **Lösungsschlüssel**

Benutze den Zahlenstrahl um jede Zahl auf die nächste Zehnerstelle zu runden.

Bsp)

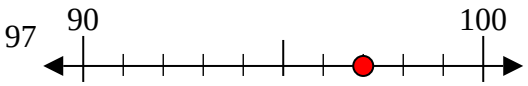

1)

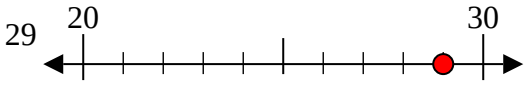

2)

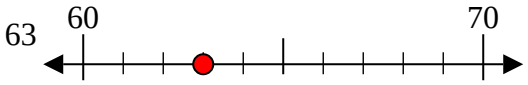

3)

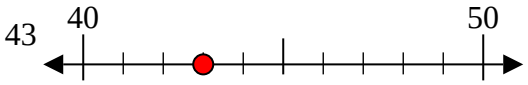

4)

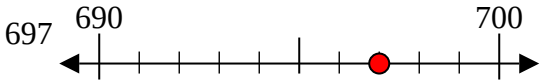

5)

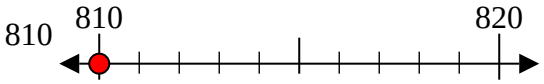

6)

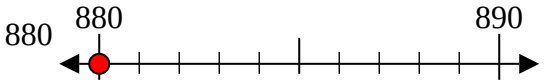

7)

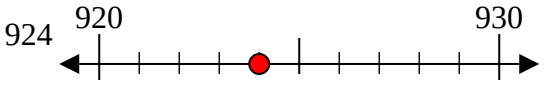

8)

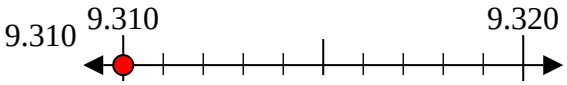

9)

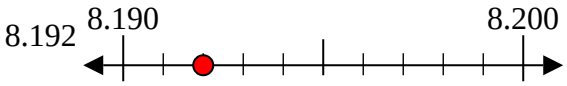

Antworten

Bsp.	100
1.	30
2.	60
3.	40
4.	700
5.	810
6.	880
7.	920
8.	9310
9.	8190

1-9	89	78	67	56	44	33	22	11	0

Runden auf 10er (mit Zahlenstrahl) Name:

Benutze den Zahlenstrahl um jede Zahl auf die nächste Zehnerstelle zu runden.

Bsp) 36

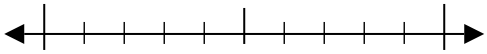

1) 68

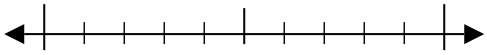

2) 71

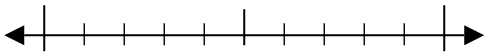

3) 52

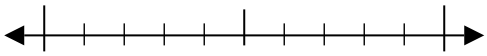

4) 324

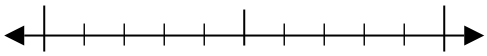

5) 123

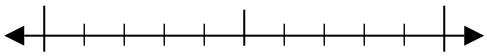

6) 937

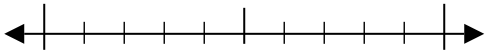

7) 221

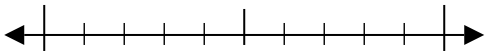

8) 9.895

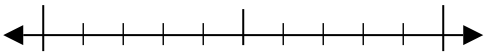

9) 4.063

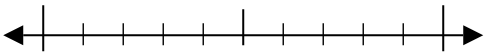

Antworten

Bsp. 40

1. _____
2. _____
3. _____
4. _____
5. _____
6. _____
7. _____
8. _____
9. _____

1-9	89	78	67	56	44	33	22	11	0

Runden auf 10er (mit Zahlenstrahl) Name: **Lösungsschlüssel**

Benutze den Zahlenstrahl um jede Zahl auf die nächste Zehnerstelle zu runden.

Bsp)

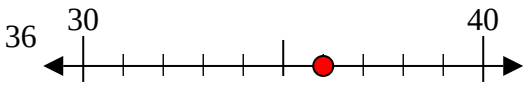

1)

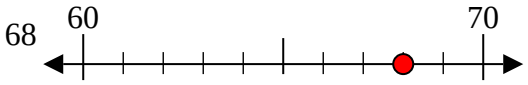

2)

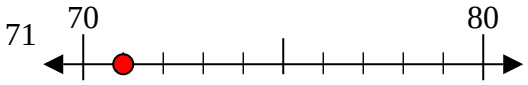

3)

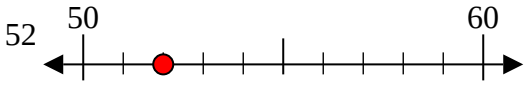

4)

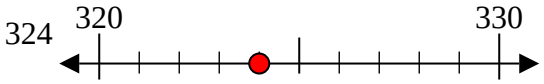

5)

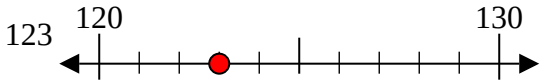

6)

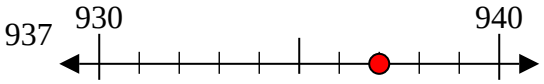

7)

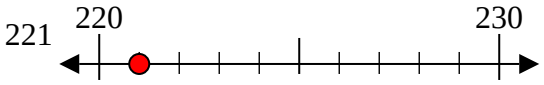

8)

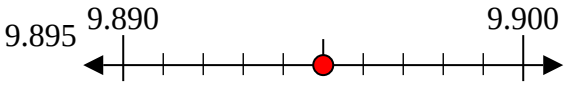

9)

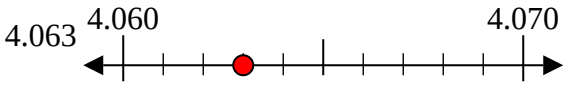

Antworten

Bsp.	40
1.	70
2.	70
3.	50
4.	320
5.	120
6.	940
7.	220
8.	9900
9.	4060

1-9	89	78	67	56	44	33	22	11	0

Runden auf 10er (mit Zahlenstrahl) Name:

Benutze den Zahlenstrahl um jede Zahl auf die nächste Zehnerstelle zu runden.

Bsp) 44

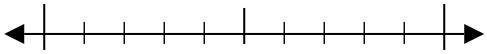

1) 94

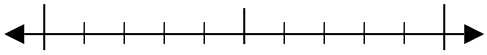

2) 21

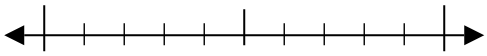

3) 44

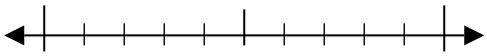

4) 158

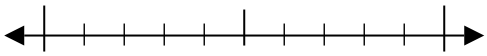

5) 990

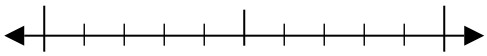

6) 335

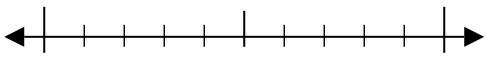

7) 288

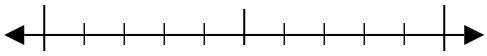

8) 3.793

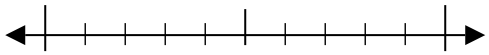

9) 9.045

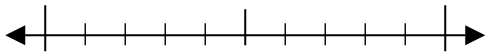

Antworten

Bsp. 40

1. _____
2. _____
3. _____
4. _____
5. _____
6. _____
7. _____
8. _____
9. _____

1-9	89	78	67	56	44	33	22	11	0

Runden auf 10er (mit Zahlenstrahl) Name: **Lösungsschlüssel**

Benutze den Zahlenstrahl um jede Zahl auf die nächste Zehnerstelle zu runden.

Bsp)

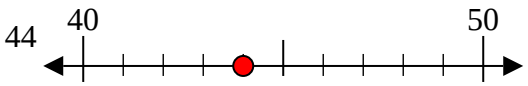

1)

2)

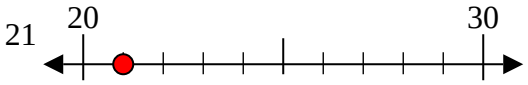

3)

4)

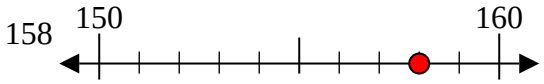

5)

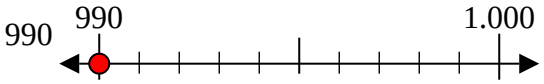

6)

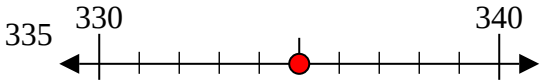

7)

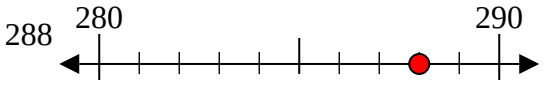

8)

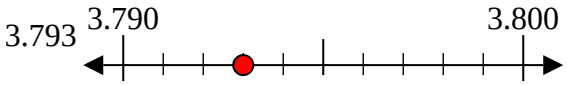

9)

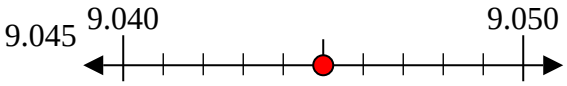

Antworten

Bsp.	40
1.	90
2.	20
3.	40
4.	160
5.	990
6.	340
7.	290
8.	3790
9.	9050

1-9	89	78	67	56	44	33	22	11	0

Runden auf 10er (mit Zahlenstrahl) Name:

Benutze den Zahlenstrahl um jede Zahl auf die nächste Zehnerstelle zu runden.

Bsp) 51

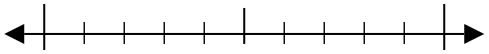

1) 83

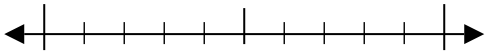

2) 49

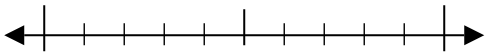

3) 62

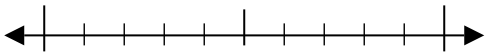

4) 726

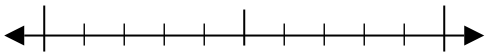

5) 716

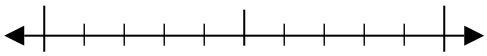

6) 813

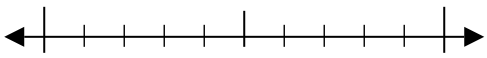

7) 131

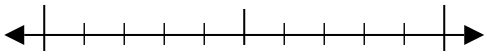

8) 5.409

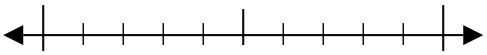

9) 8.102

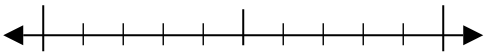

Antworten

Bsp. 50

1. _____
2. _____
3. _____
4. _____
5. _____
6. _____
7. _____
8. _____
9. _____

1-9	89	78	67	56	44	33	22	11	0

Runden auf 10er (mit Zahlenstrahl) Name: **Lösungsschlüssel**

Benutze den Zahlenstrahl um jede Zahl auf die nächste Zehnerstelle zu runden.

Bsp)

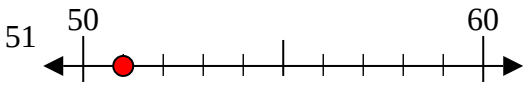

1)

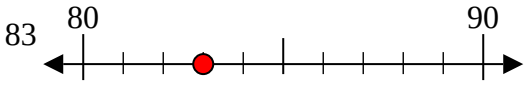

2)

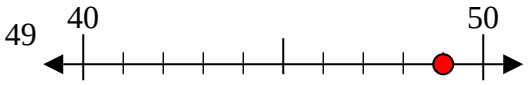

3)

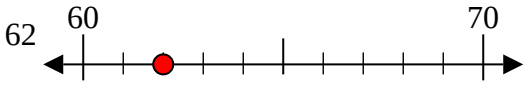

4)

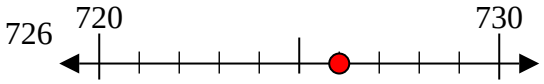

5)

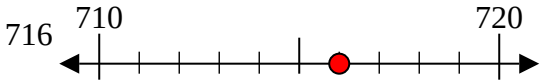

6)

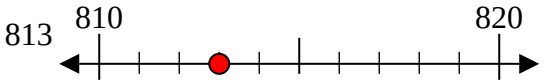

7)

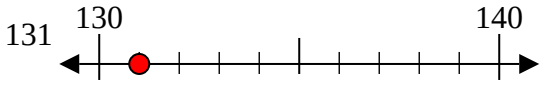

8)

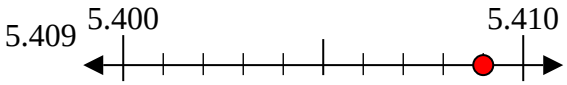

9)

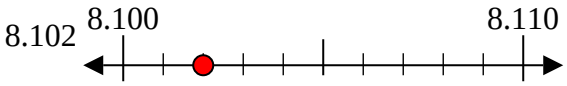

Antworten

Bsp.	50
1.	80
2.	50
3.	60
4.	730
5.	720
6.	810
7.	130
8.	5410
9.	8100

1-9	89	78	67	56	44	33	22	11	0

Runden auf 10er (mit Zahlenstrahl) Name:

Benutze den Zahlenstrahl um jede Zahl auf die nächste Zehnerstelle zu runden.

Bsp) 32

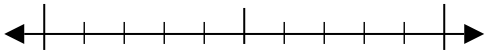

1) 46

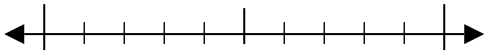

2) 35

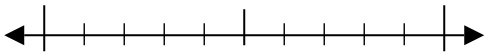

3) 57

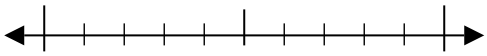

4) 150

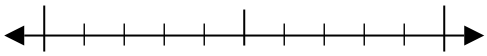

5) 423

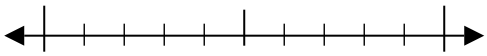

6) 948

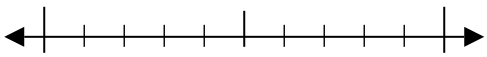

7) 493

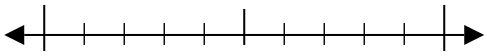

8) 7.709

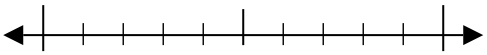

9) 4.807

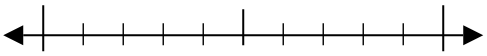

Antworten

Bsp. 30

1. _____
2. _____
3. _____
4. _____
5. _____
6. _____
7. _____
8. _____
9. _____

1-9	89	78	67	56	44	33	22	11	0

Runden auf 10er (mit Zahlenstrahl) Name: **Lösungsschlüssel**

Benutze den Zahlenstrahl um jede Zahl auf die nächste Zehnerstelle zu runden.

Bsp)

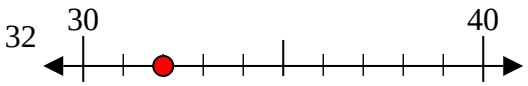

1)

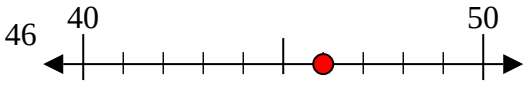

2)

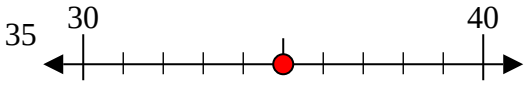

3)

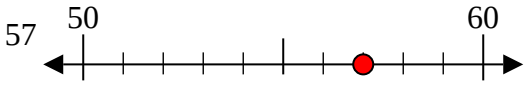

4)

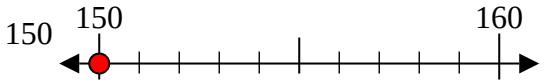

5)

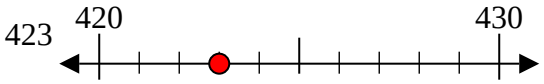

6)

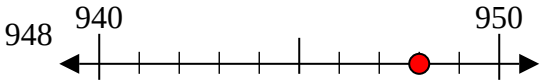

7)

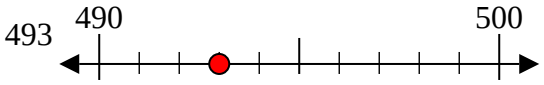

8)

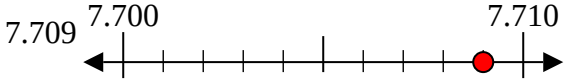

9)

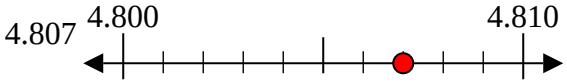

Antworten

Bsp.	30
1.	50
2.	40
3.	60
4.	150
5.	420
6.	950
7.	490
8.	7710
9.	4810

1-9	89	78	67	56	44	33	22	11	0

Runden auf 10er (mit Zahlenstrahl) Name:

Benutze den Zahlenstrahl um jede Zahl auf die nächste Zehnerstelle zu runden.

Bsp) 26

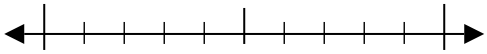

1) 99

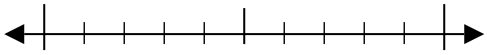

2) 50

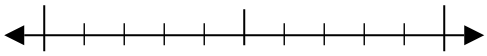

3) 94

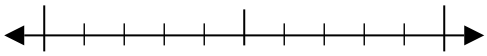

4) 481

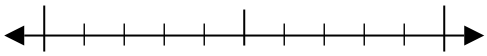

5) 461

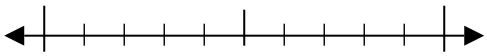

6) 576

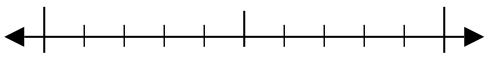

7) 598

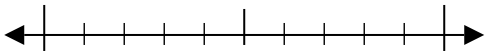

8) 1.791

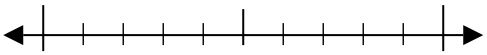

9) 4.128

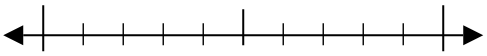

Antworten

Bsp. 30

1. _____
2. _____
3. _____
4. _____
5. _____
6. _____
7. _____
8. _____
9. _____

1-9	89	78	67	56	44	33	22	11	0

Runden auf 10er (mit Zahlenstrahl) Name: **Lösungsschlüssel**

Benutze den Zahlenstrahl um jede Zahl auf die nächste Zehnerstelle zu runden.

Bsp)

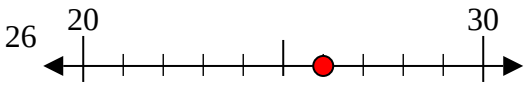

1)

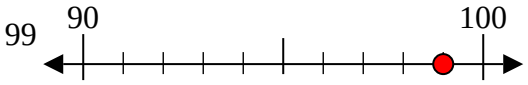

2)

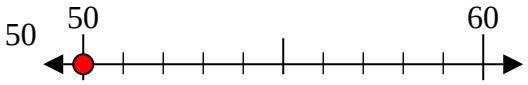

3)

4)

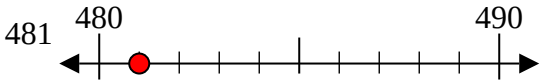

5)

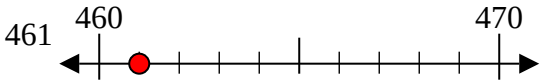

6)

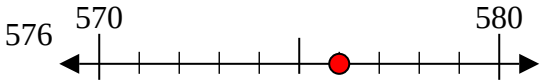

7)

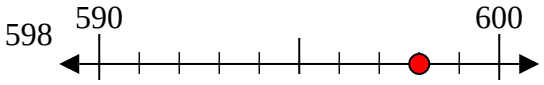

8)

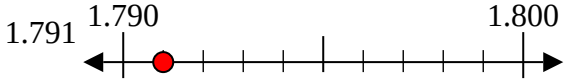

9)

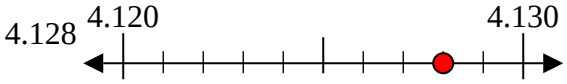

Antworten

Bsp.	30
1.	100
2.	50
3.	90
4.	480
5.	460
6.	580
7.	600
8.	1790
9.	4130

1-9	89	78	67	56	44	33	22	11	0

Runden auf 10er (mit Zahlenstrahl) Name:

Benutze den Zahlenstrahl um jede Zahl auf die nächste Zehnerstelle zu runden.

Bsp) 95

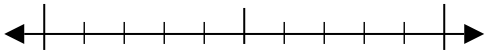

1) 95

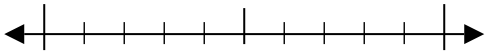

2) 27

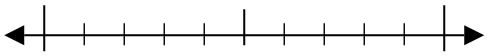

3) 84

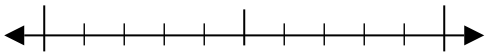

4) 110

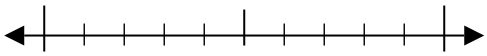

5) 415

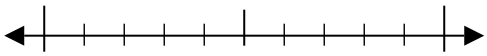

6) 408

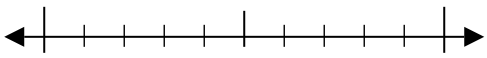

7) 428

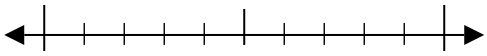

8) 5.370

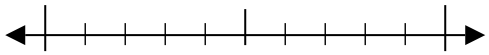

9) 7.902

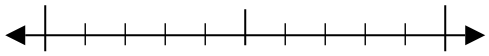

Antworten

Bsp. **100**

1. _____
2. _____
3. _____
4. _____
5. _____
6. _____
7. _____
8. _____
9. _____

1-9	89	78	67	56	44	33	22	11	0

Runden auf 10er (mit Zahlenstrahl) Name: **Lösungsschlüssel**

Benutze den Zahlenstrahl um jede Zahl auf die nächste Zehnerstelle zu runden.

Bsp)

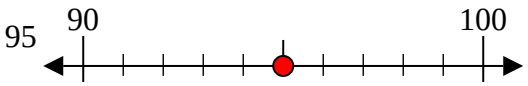

1)

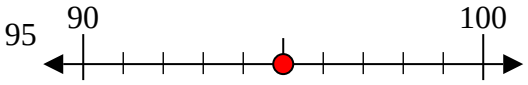

2)

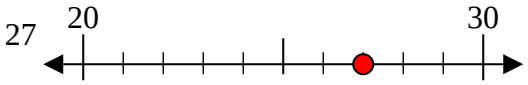

3)

4)

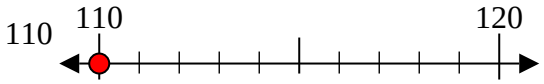

5)

6)

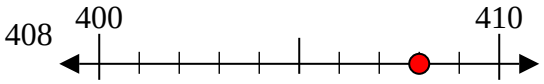

7)

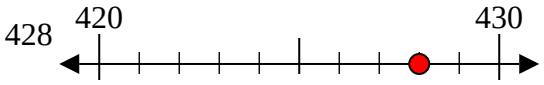

8)

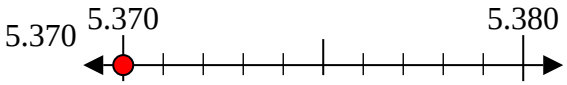

9)

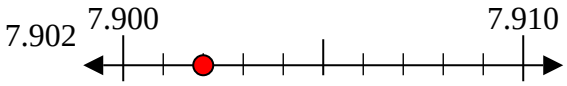

Antworten

Bsp.	100
1.	100
2.	30
3.	80
4.	110
5.	420
6.	410
7.	430
8.	5370
9.	7900

1-9	89	78	67	56	44	33	22	11	0