Runden auf 10er (mit Zahlenstrahl) Name:

**Benutze den Zahlenstrahl um jede Zahl auf die nächste Zehnerstelle zu runden.**

**Bsp)** 97

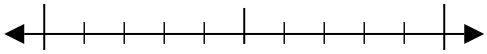

**1)** 29

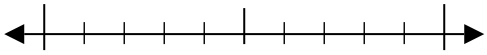

**2)** 63

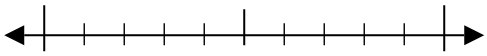

**3)** 43

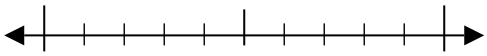

**4)** 697

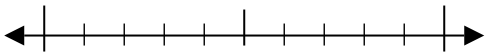

**5)** 810

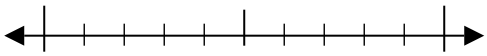

**6)** 880

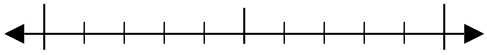

**7)** 924

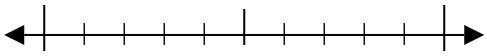

**8)** 9.310

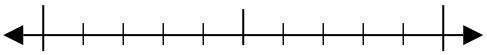

**9)** 8.192

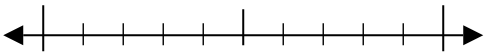

**Antworten**

Bsp. **100**

1. _____
2. _____
3. _____
4. _____
5. _____
6. _____
7. _____
8. _____
9. _____



| 1-9 | 89 | 78 | 67 | 56 | 44 | 33 | 22 | 11 | 0 |
|---|---|---|---|---|---|---|---|---|---|

Runden auf 10er (mit Zahlenstrahl) Name: **Lösungsschlüssel**

**Benutze den Zahlenstrahl um jede Zahl auf die nächste Zehnerstelle zu runden.**

**Bsp)**

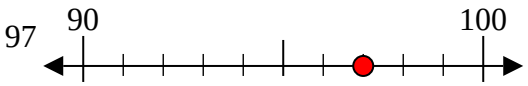


**1)**

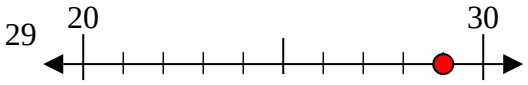


**2)**

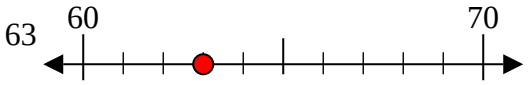


**3)**

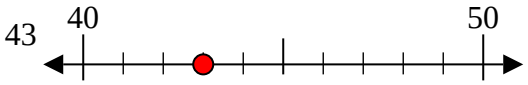


**4)**

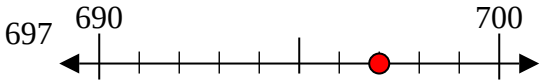


**5)**

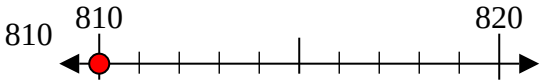


**6)**

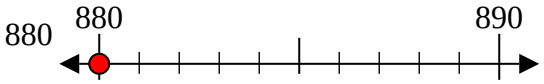


**7)**

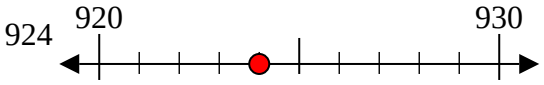


**8)**

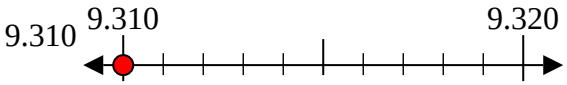


**9)**

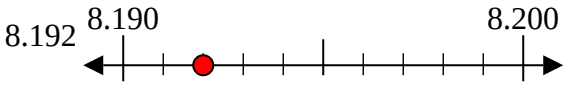


**Antworten**

| | |
|---|---|
| Bsp. | 100 |
| 1. | 30 |
| 2. | 60 |
| 3. | 40 |
| 4. | 700 |
| 5. | 810 |
| 6. | 880 |
| 7. | 920 |
| 8. | 9310 |
| 9. | 8190 |



| 1-9 | 89 | 78 | 67 | 56 | 44 | 33 | 22 | 11 | 0 |
|---|---|---|---|---|---|---|---|---|---|