Bestimmen Sie, was der Wert von A in jedem Problem bedeutet.

1)

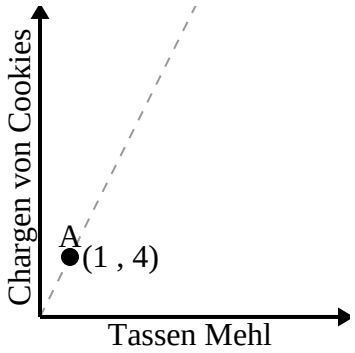

2)

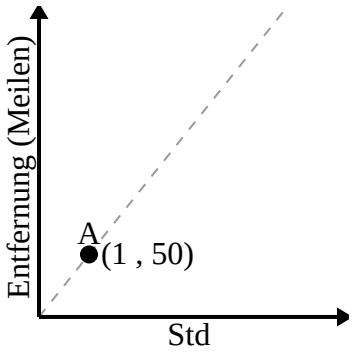

3)

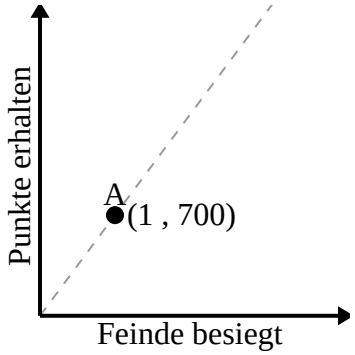

4)

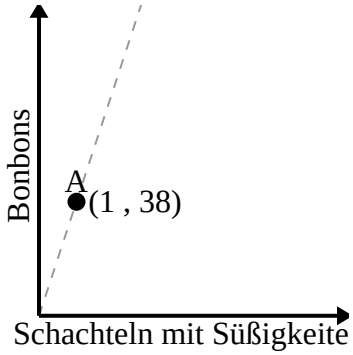

5)

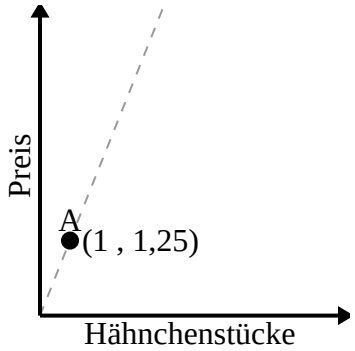

6)

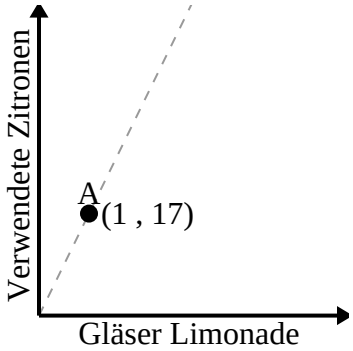

1-6	83	67	50	33	17	0

Bestimmen Sie, was der Wert von A in jedem Problem bedeutet.

1)

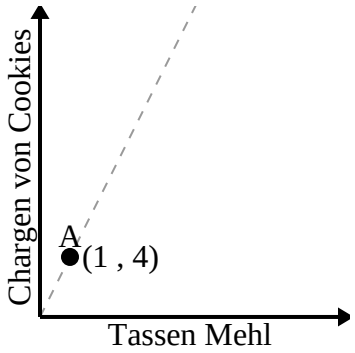

Für jede Tasse Mehl können 4 Chargen von Keksen hergestellt werden.

2)

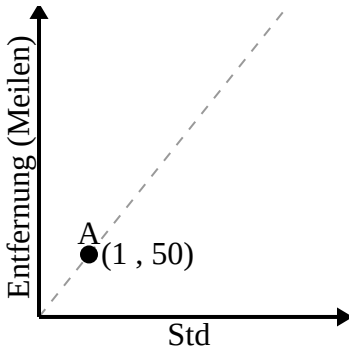

Jede Stunde werden 50 Meilen zurückgelegt.

3)

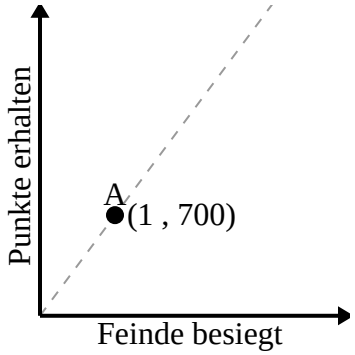

Für jeden besiegten Feind werden 700 Punkte verdient.

4)

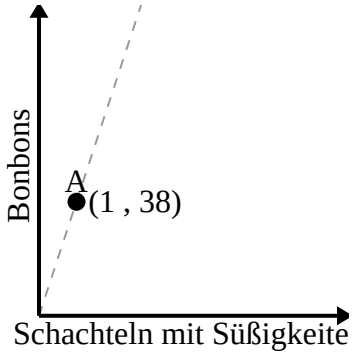

Jede Schachtel Bonbons enthält 38 Bonbons.

5)

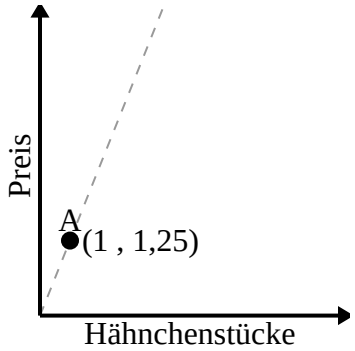

Jedes Stück Hühnchen kostet $1.25.

6)

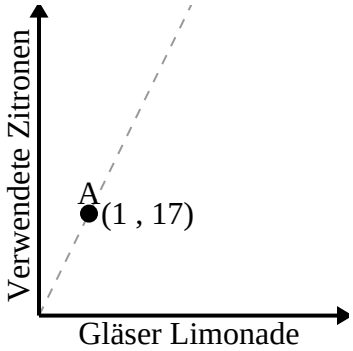

Jedes Glas Limonade benötigt 17 Zitronen.

1-6	83	67	50	33	17	0