Bestimmung der Spinner-Wahrscheinlichkeit

Name:

Löse jede Aufgabe.

1) Which number is the spinner least likely to land on?



2) Which letter is the spinner most likely to land on?

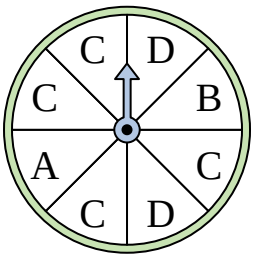

3) Which letter is the spinner least likely to land on?

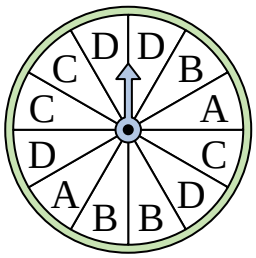

4) Which number is the spinner most likely to land on?



5) Which letter is the spinner most likely to land on?

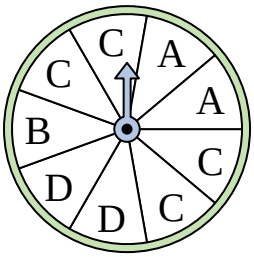

6) Which two numbers is the spinner equally likely to land on?

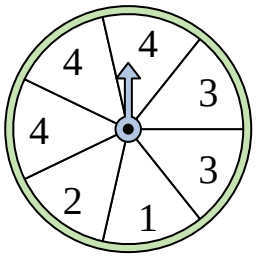

7) Which number is the spinner least likely to land on?



8) Which number is the spinner most likely to land on?



9) Which number is the spinner most likely to land on?

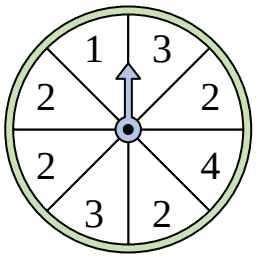

10) Which letter is the spinner least likely to land on?

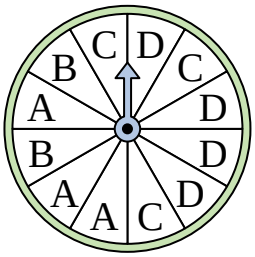

11) Which number is the spinner most likely to land on?



12) Which two letters is the spinner equally likely to land on?

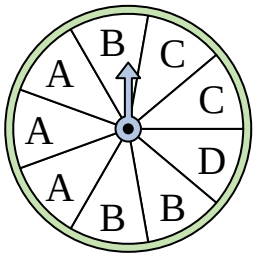

Antworten

1. _____
2. _____
3. _____
4. _____
5. _____
6. _____
7. _____
8. _____
9. _____
10. _____
11. _____
12. _____

1-10	92	83	75	67	58	50	42	33	25	17
11-12	8	0								

Löse jede Aufgabe.

1) Which number is the spinner least likely to land on?



2) Which letter is the spinner most likely to land on?

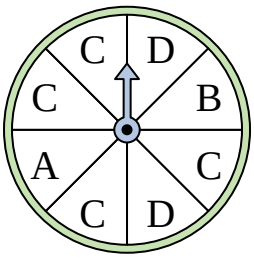

3) Which letter is the spinner least likely to land on?

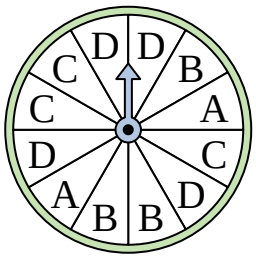

4) Which number is the spinner most likely to land on?



5) Which letter is the spinner most likely to land on?

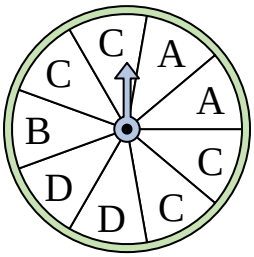

6) Which two numbers is the spinner equally likely to land on?

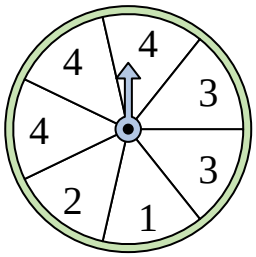

7) Which number is the spinner least likely to land on?



8) Which number is the spinner most likely to land on?



9) Which number is the spinner most likely to land on?

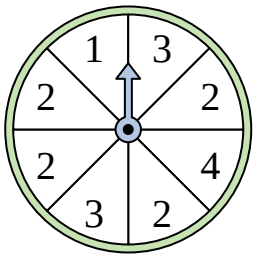

10) Which letter is the spinner least likely to land on?

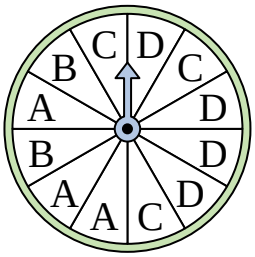

11) Which number is the spinner most likely to land on?



12) Which two letters is the spinner equally likely to land on?

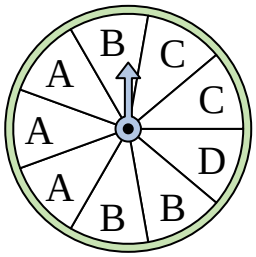

Antworten

1. **4**
2. **C**
3. **A**
4. **3**
5. **C**
6. **1 & 2**
7. **2**
8. **1**
9. **2**
10. **B**
11. **3**
12. **A & B**

1-10	92	83	75	67	58	50	42	33	25	17
11-12	8	0								