Ungleichheiten auf dem Zahlenstrahl

Name:

Löse jede Aufgabe.

1) Bestimme, welche Möglichkeit X < -17 anzeigt.

A.

B.

C. 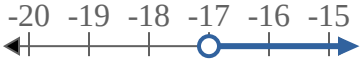

D. 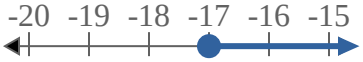

2) Bestimme, welche Möglichkeit X ≤ 20 anzeigt.

A.

B. 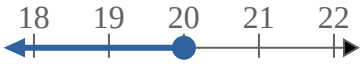

C.

D. 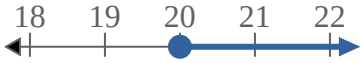

3) Bestimme, welche Möglichkeit X ≥ 12 anzeigt.

A. 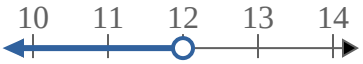

B. 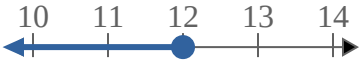

C.

D. 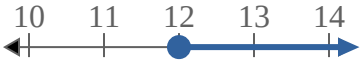

4) Bestimme, welche Möglichkeit X ≥ -17 anzeigt.

A.

B.

C.

D.

5) Bestimme, welche Möglichkeit X ≥ 6 anzeigt.

A.

B. 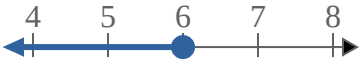

C.

D. 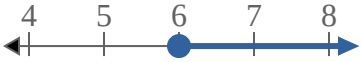

6) Bestimme, welche Möglichkeit X ≤ 11 anzeigt.

A.

B.

C. 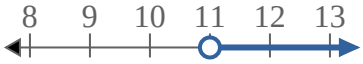

D.

7) Bestimme, welche Möglichkeit X ≤ -8 anzeigt.

A. 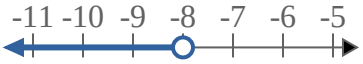

B. 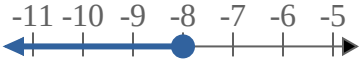

C. 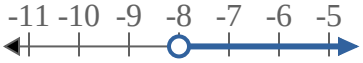

D. 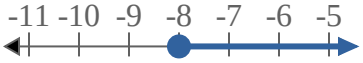

8) Bestimme, welche Möglichkeit X > 2 anzeigt.

A.

B.

C.

D.

Antworten

1. _____
2. _____
3. _____
4. _____
5. _____
6. _____
7. _____
8. _____

1-8	88	75	63	50	38	25	13	0

Ungleichheiten auf dem Zahlenstrahl

Name: **Lösungsschlüssel**

Löse jede Aufgabe.

1) Bestimme, welche Möglichkeit X < -17 anzeigt.

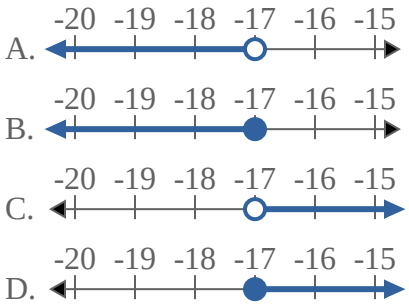

2) Bestimme, welche Möglichkeit X ≤ 20 anzeigt.

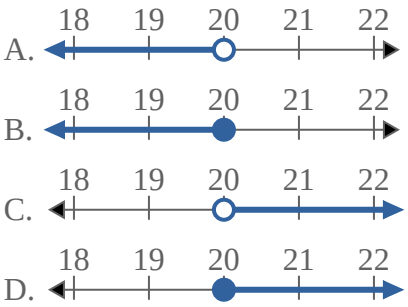

3) Bestimme, welche Möglichkeit X ≥ 12 anzeigt.

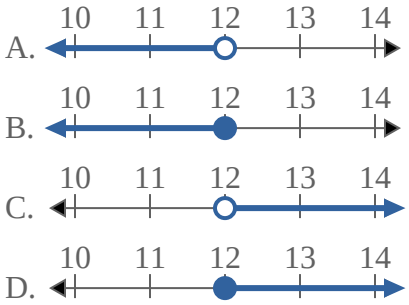

4) Bestimme, welche Möglichkeit X ≥ -17 anzeigt.

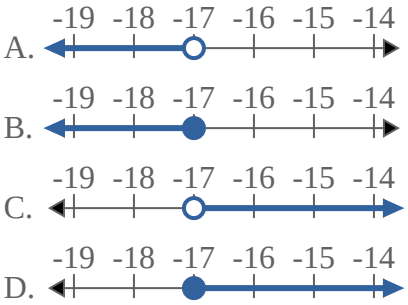

5) Bestimme, welche Möglichkeit X ≥ 6 anzeigt.

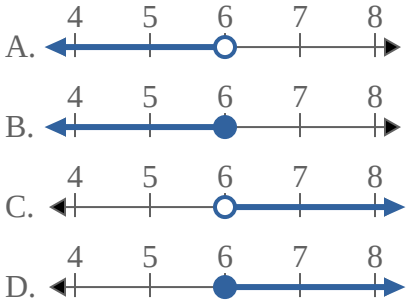

6) Bestimme, welche Möglichkeit X ≤ 11 anzeigt.

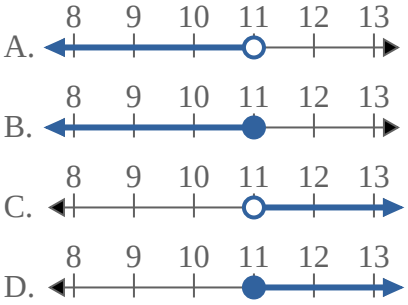

7) Bestimme, welche Möglichkeit X ≤ -8 anzeigt.

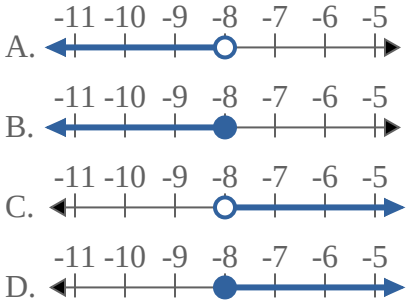

8) Bestimme, welche Möglichkeit X > 2 anzeigt.

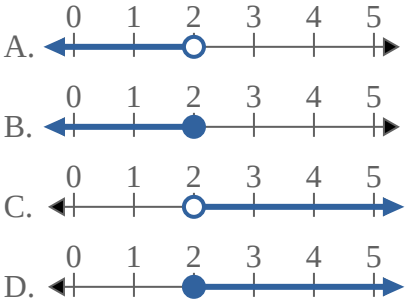

Antworten

1. A
2. B
3. D
4. D
5. D
6. B
7. B
8. C

1-8	88	75	63	50	38	25	13	0