Ungleichheiten auf dem Zahlenstrahl

Name:

Löse jede Aufgabe.

1) Bestimme, welche Möglichkeit X < 20 anzeigt.

A.

B. 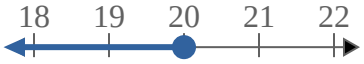

C.

D.

2) Bestimme, welche Möglichkeit X ≥ -5 anzeigt.

A.

B.

C.

D.

3) Bestimme, welche Möglichkeit X ≤ -8 anzeigt.

A. 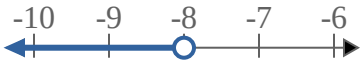

B.

C. 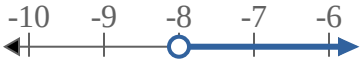

D. 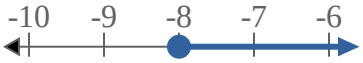

4) Bestimme, welche Möglichkeit X ≥ 6 anzeigt.

A.

B. 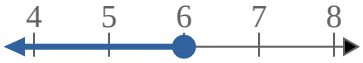

C.

D. 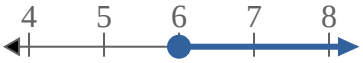

5) Bestimme, welche Möglichkeit X > -1 anzeigt.

A.

B.

C.

D.

6) Bestimme, welche Möglichkeit X ≤ 6 anzeigt.

A.

B. 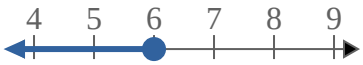

C.

D.

7) Bestimme, welche Möglichkeit X < 9 anzeigt.

A.

B. 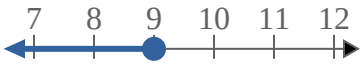

C.

D.

8) Bestimme, welche Möglichkeit X ≤ -11 anzeigt.

A.

B.

C. 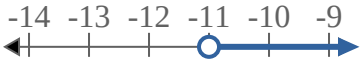

D. 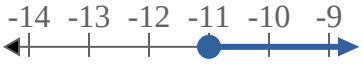

Antworten

1. _____
2. _____
3. _____
4. _____
5. _____
6. _____
7. _____
8. _____

1-8	88	75	63	50	38	25	13	0

Ungleichheiten auf dem Zahlenstrahl

Name: **Lösungsschlüssel**

Löse jede Aufgabe.

1) Bestimme, welche Möglichkeit X < 20 anzeigt.

A.

B. 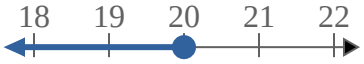

C.

D.

2) Bestimme, welche Möglichkeit X ≥ -5 anzeigt.

A.

B.

C.

D.

3) Bestimme, welche Möglichkeit X ≤ -8 anzeigt.

A. 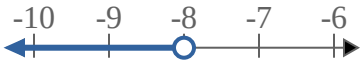

B.

C. 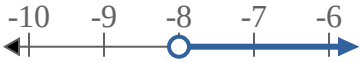

D. 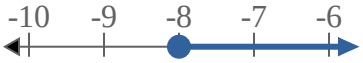

4) Bestimme, welche Möglichkeit X ≥ 6 anzeigt.

A.

B. 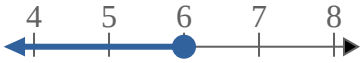

C.

D. 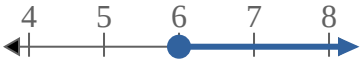

5) Bestimme, welche Möglichkeit X > -1 anzeigt.

A.

B.

C.

D.

6) Bestimme, welche Möglichkeit X ≤ 6 anzeigt.

A.

B. 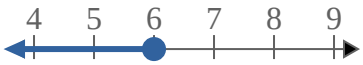

C.

D.

7) Bestimme, welche Möglichkeit X < 9 anzeigt.

A.

B. 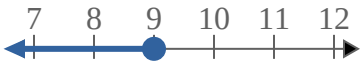

C.

D.

8) Bestimme, welche Möglichkeit X ≤ -11 anzeigt.

A.

B.

C. 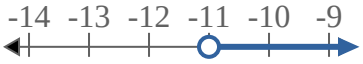

D. 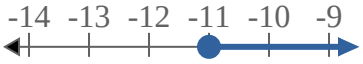

Antworten

1. A
2. D
3. B
4. D
5. C
6. B
7. A
8. B

1-8	88	75	63	50	38	25	13	0