Funktionen identifizieren (Grafiken) Name:

Bestimmen Sie, ob jeder gezeigte Graph eine Funktion darstellt (ja) oder nicht (nein). In der Gleichung steht x für die Eingabe und y für die Ausgabe.

1)

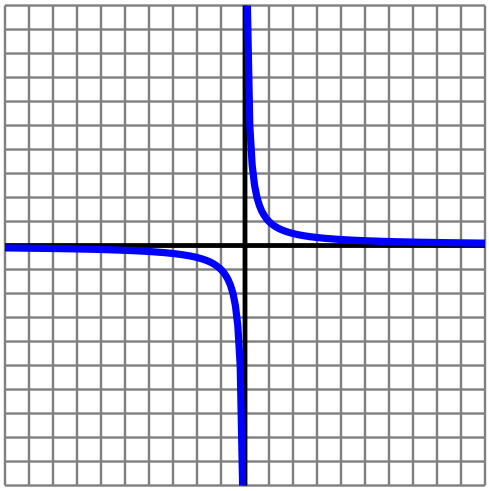

$y = x^{-1}$

2)

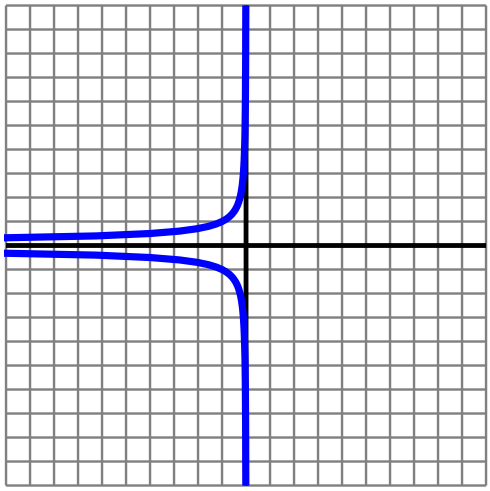

$y^{-2} = -x$

3)

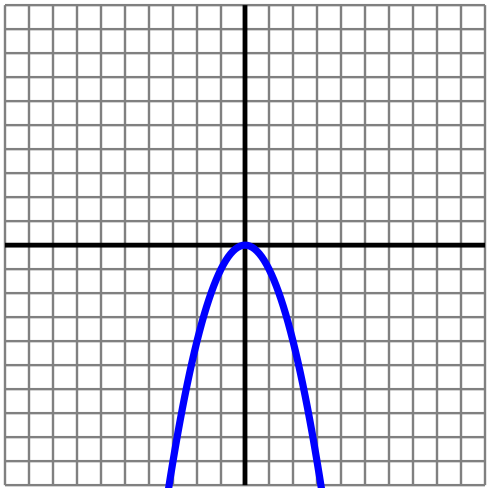

$-y = x^{2}$

4)

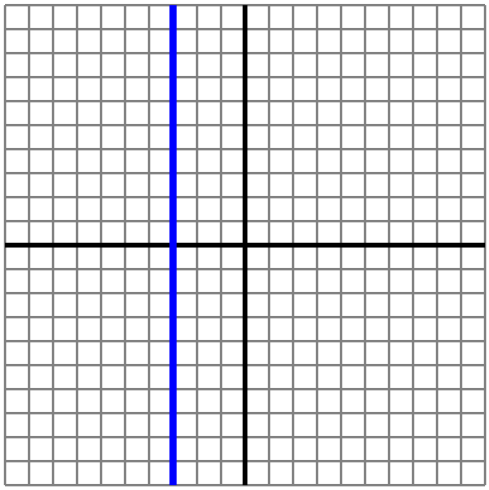

$x = -3$

5)

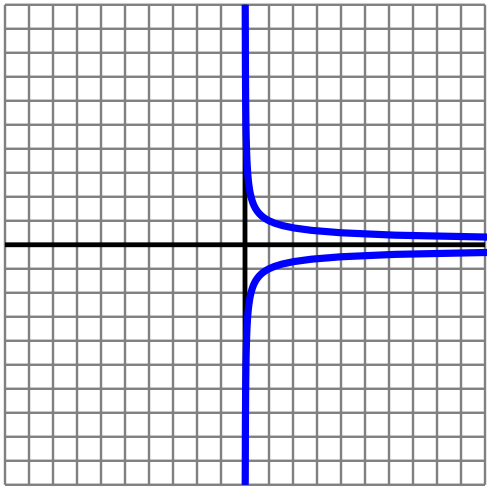

$x = y^{-2}$

6)

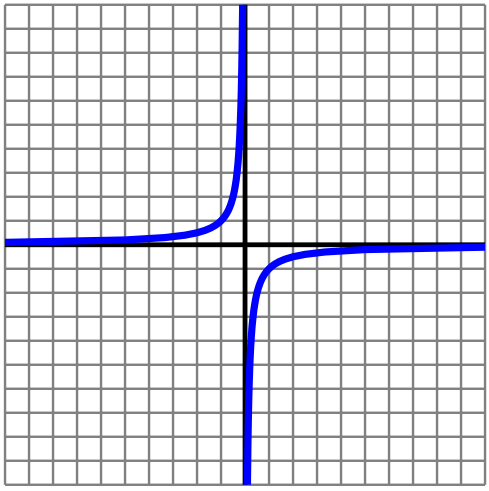

$y^{-1} = -x$

Antworten

1. _____
2. _____
3. _____
4. _____
5. _____
6. _____

1-6	83	67	50	33	17	0

Funktionen identifizieren (Grafiken) Name: **Lösungsschlüssel**

Bestimmen Sie, ob jeder gezeigte Graph eine Funktion darstellt (ja) oder nicht (nein). In der Gleichung steht x für die Eingabe und y für die Ausgabe.

1)

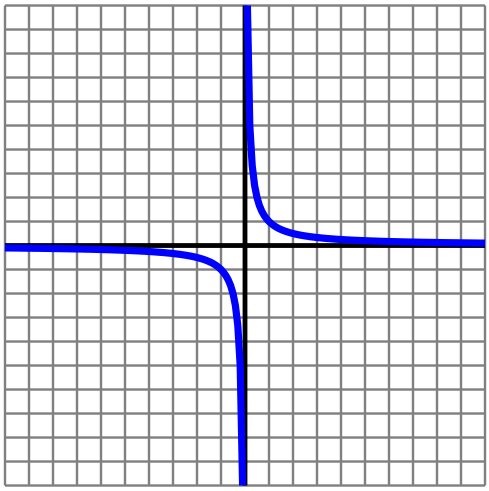

$y = x^{-1}$

2)

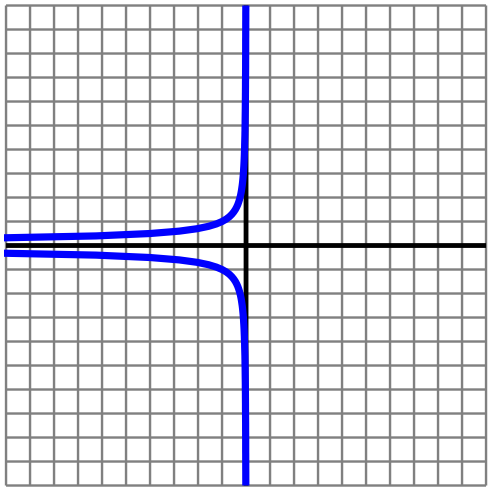

$y^{-2} = -x$

3)

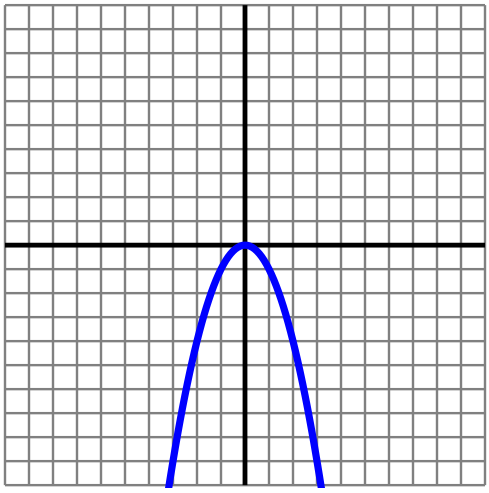

$-y = x^{2}$

4)

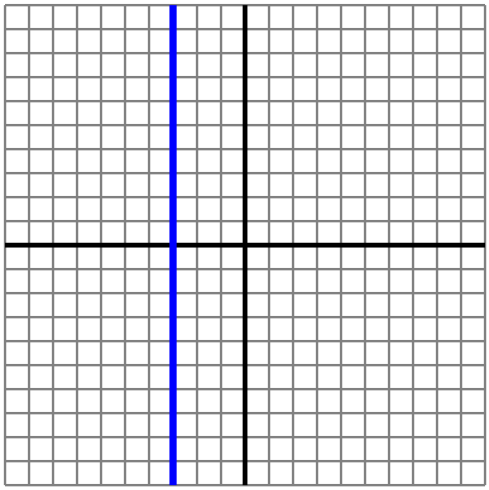

$x = -3$

5)

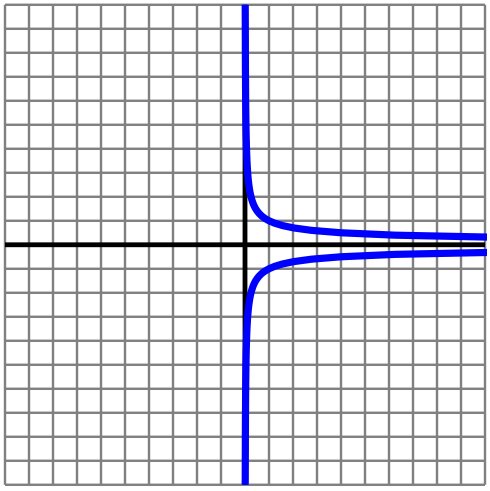

$x = y^{-2}$

6)

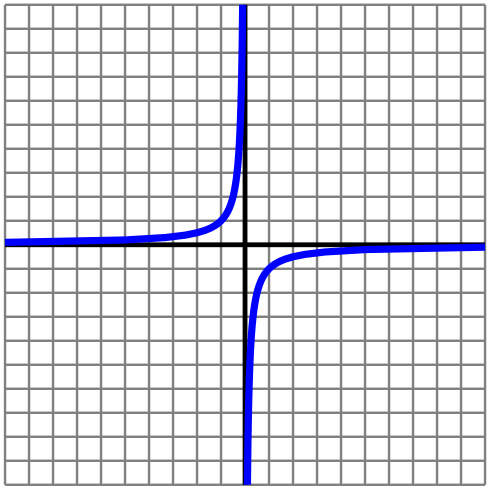

$y^{-1} = -x$

Antworten

1. **ja**
2. **nein**
3. **ja**
4. **nein**
5. **nein**
6. **ja**

1-6	83	67	50	33	17	0