Stelle fest, welche Regel die Funktionsmaschine anwendet.

Bsp)

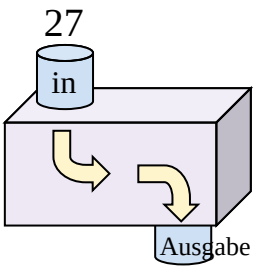

12 hinzufügen

1)

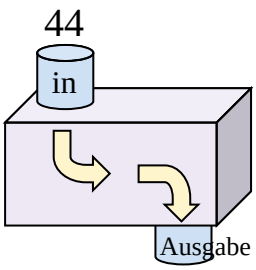

2)

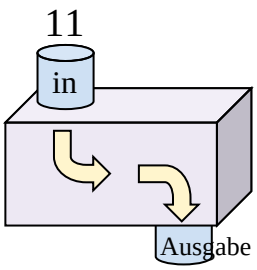

3)

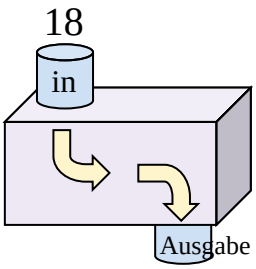

4)

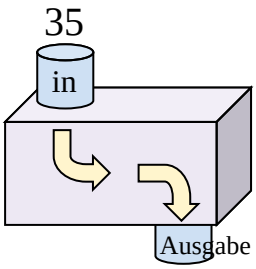

5)

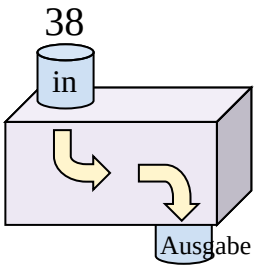

6)

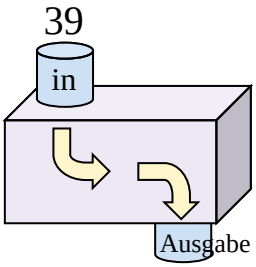

7)

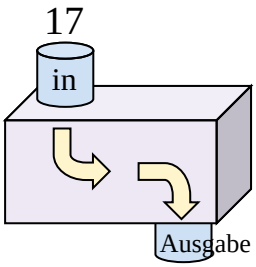

8)

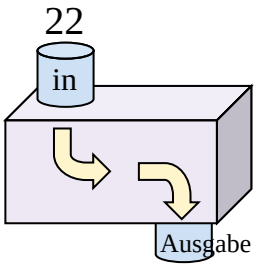

9)

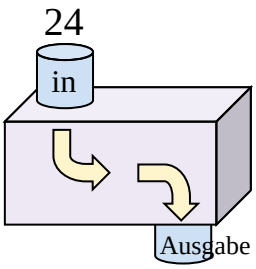

10)

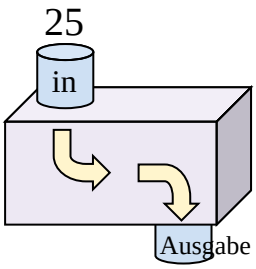

11)

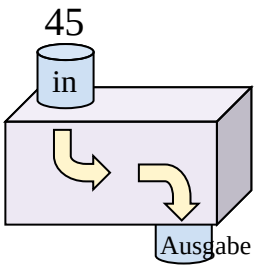

Antworten

Bsp. 12 hinzufügen

1. _____
2. _____
3. _____
4. _____
5. _____
6. _____
7. _____
8. _____
9. _____
10. _____
11. _____

1-10	91	82	73	64	55	45	36	27	18	9
11	0									

Stelle fest, welche Regel die Funktionsmaschine anwendet.

Bsp)

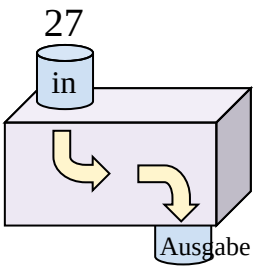

12 hinzufügen

1)

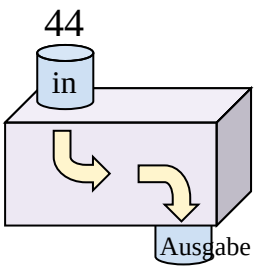

Subtrahieren von 30

2)

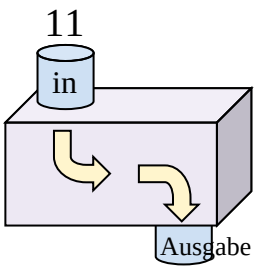

8 hinzufügen

3)

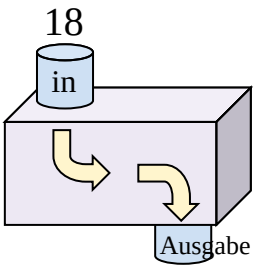

30 hinzufügen

4)

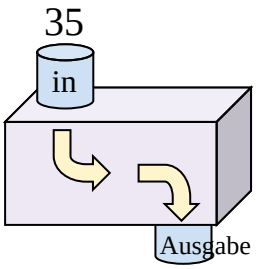

Subtrahieren von 26

5)

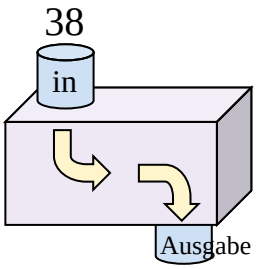

Subtrahieren von 22

6)

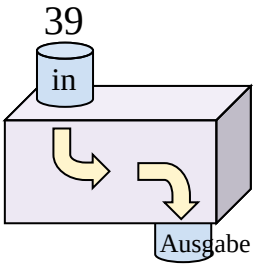

Subtrahieren von 21

7)

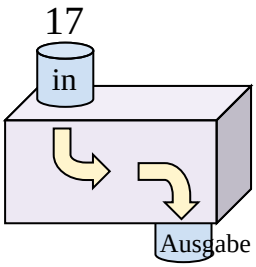

18 hinzufügen

8)

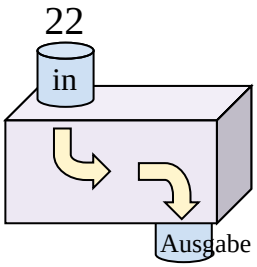

Subtrahieren von 5

9)

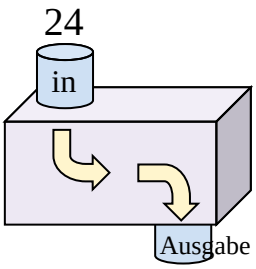

12 hinzufügen

10)

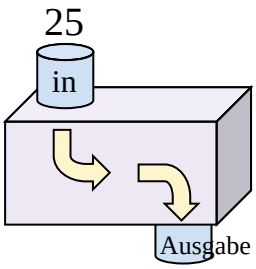

18 hinzufügen

11)

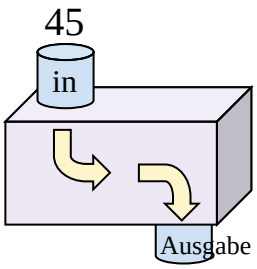

Subtrahieren von 35

Antworten

Bsp.	12 hinzufügen
1.	Subtrahieren von 30
2.	8 hinzufügen
3.	30 hinzufügen
4.	Subtrahieren von 26
5.	Subtrahieren von 22
6.	Subtrahieren von 21
7.	18 hinzufügen
8.	Subtrahieren von 5
9.	12 hinzufügen
10.	18 hinzufügen
11.	Subtrahieren von 35

1-10	91	82	73	64	55	45	36	27	18	9
11	0									