Stelle fest, welche Regel die Funktionsmaschine anwendet.

Bsp)

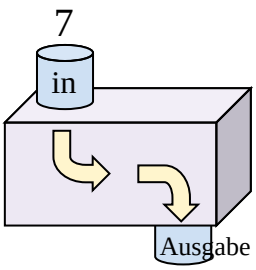

13 hinzufügen

1)

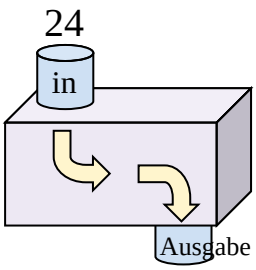

2)

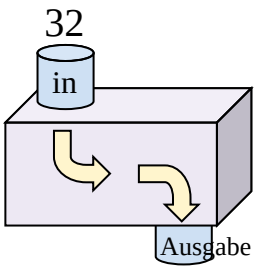

3)

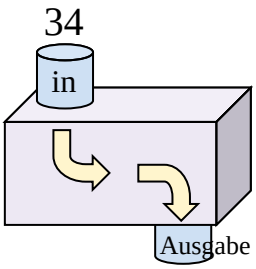

4)

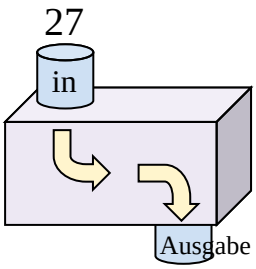

5)

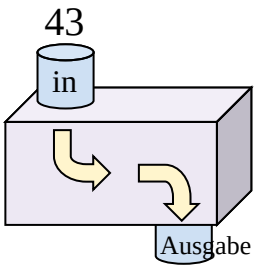

6)

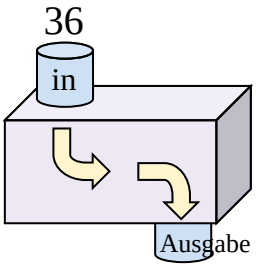

7)

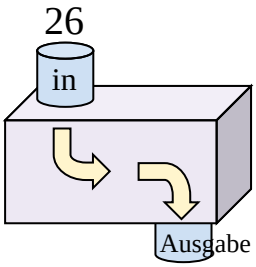

8)

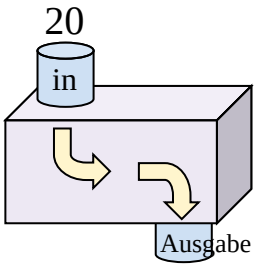

9)

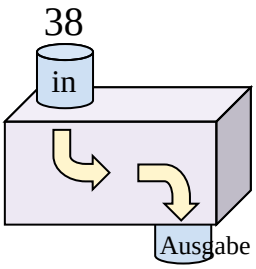

10)

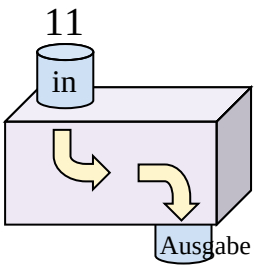

11)

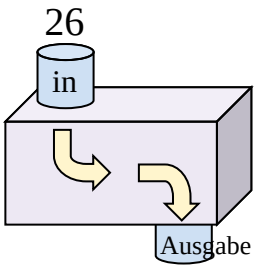

Antworten

Bsp. 13 hinzufügen

1. _____
2. _____
3. _____
4. _____
5. _____
6. _____
7. _____
8. _____
9. _____
10. _____
11. _____

1-10	91	82	73	64	55	45	36	27	18	9
11	0									

Stelle fest, welche Regel die Funktionsmaschine anwendet.

Bsp)

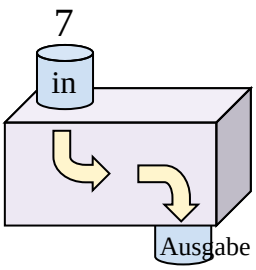

13 hinzufügen

1)

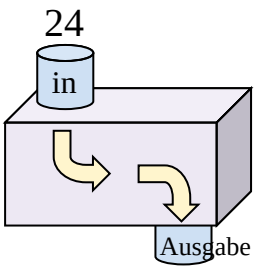

9 hinzufügen

2)

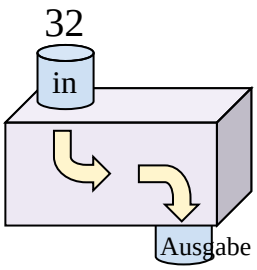

Subtrahieren von 23

3)

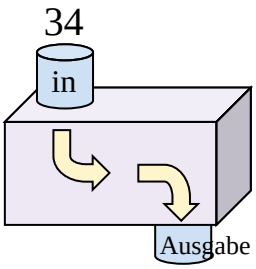

Subtrahieren von 5

4)

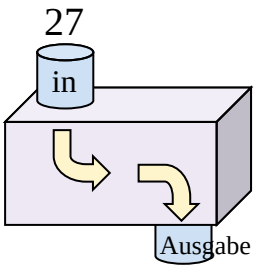

10 hinzufügen

5)

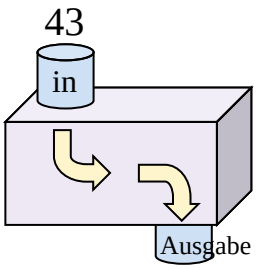

Subtrahieren von 17

6)

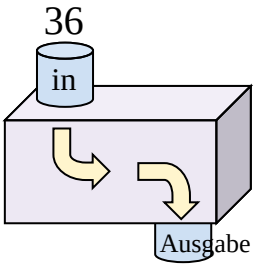

Subtrahieren von 16

7)

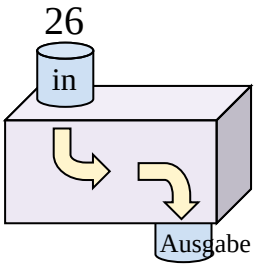

5 hinzufügen

8)

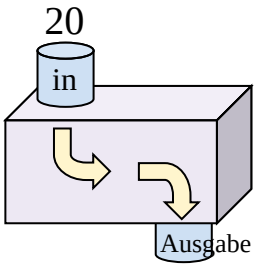

13 hinzufügen

9)

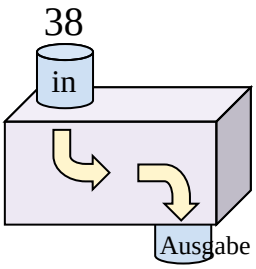

Subtrahieren von 26

10)

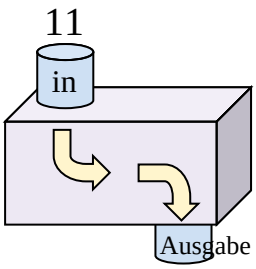

8 hinzufügen

11)

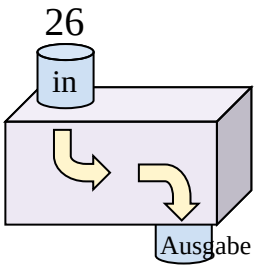

Subtrahieren von 16

Antworten

Bsp.	13 hinzufügen
1.	9 hinzufügen
2.	Subtrahieren von 23
3.	Subtrahieren von 5
4.	10 hinzufügen
5.	Subtrahieren von 17
6.	Subtrahieren von 16
7.	5 hinzufügen
8.	13 hinzufügen
9.	Subtrahieren von 26
10.	8 hinzufügen
11.	Subtrahieren von 16

1-10	91	82	73	64	55	45	36	27	18	9
11	0									