Stelle fest, welche Regel die Funktionsmaschine anwendet.

Bsp)

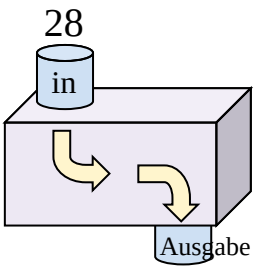

8 hinzufügen

1)

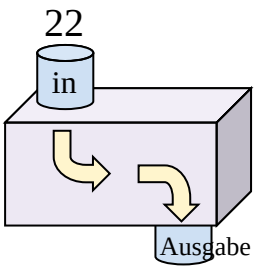

2)

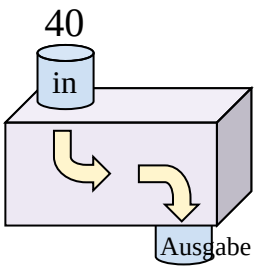

3)

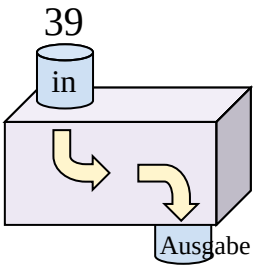

4)

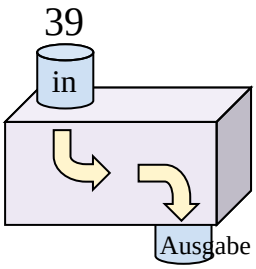

5)

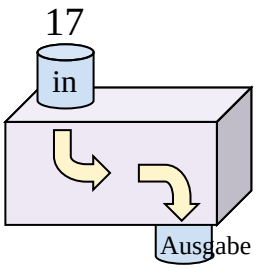

6)

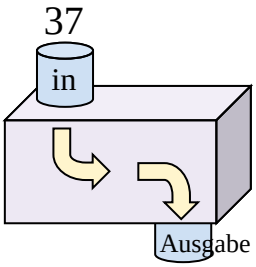

7)

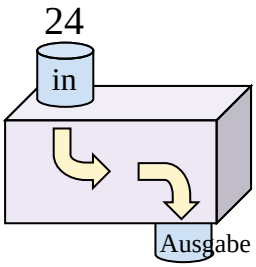

8)

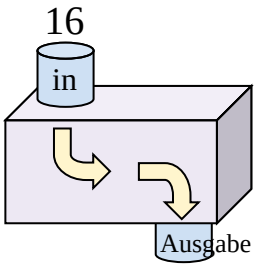

9)

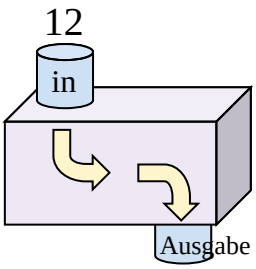

10)

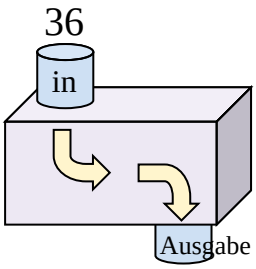

11)

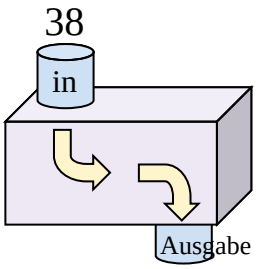

Antworten

Bsp. 8 hinzufügen

1. _____
2. _____
3. _____
4. _____
5. _____
6. _____
7. _____
8. _____
9. _____
10. _____
11. _____

1-10	91	82	73	64	55	45	36	27	18	9
11	0									

Stelle fest, welche Regel die Funktionsmaschine anwendet.

Bsp)

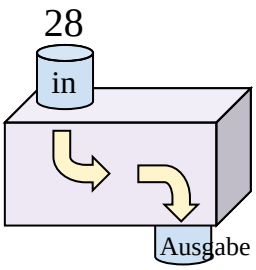

8 hinzufügen

1)

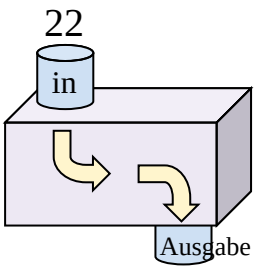

6 hinzufügen

2)

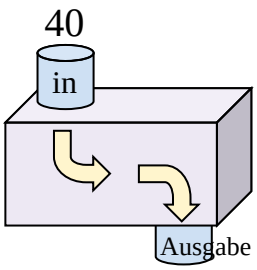

Subtrahieren von 16

3)

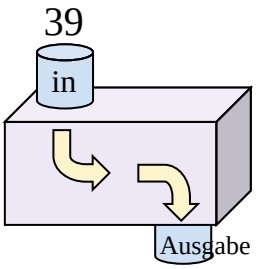

Subtrahieren von 17

4)

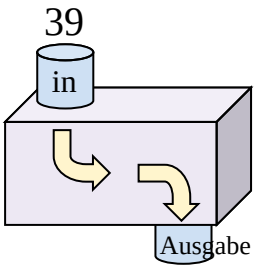

Subtrahieren von 32

5)

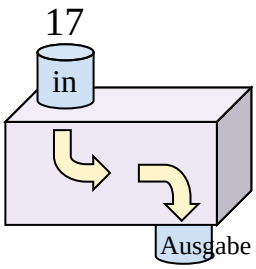

Subtrahieren von 6

6)

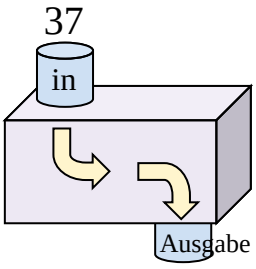

Subtrahieren von 14

7)

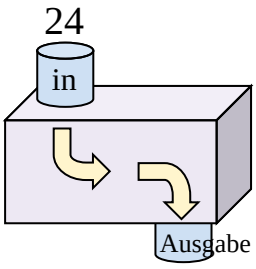

18 hinzufügen

8)

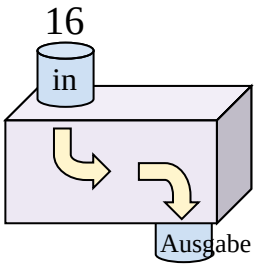

33 hinzufügen

9)

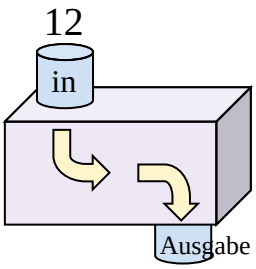

34 hinzufügen

10)

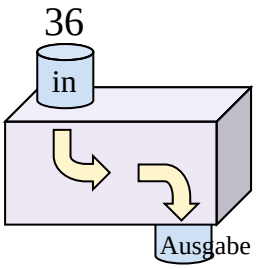

Subtrahieren von 26

11)

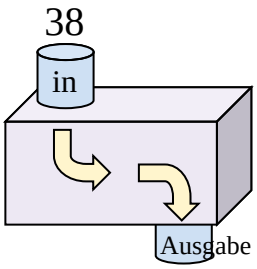

Subtrahieren von 9

Antworten

Bsp.	8 hinzufügen
1.	6 hinzufügen
2.	Subtrahieren von 16
3.	Subtrahieren von 17
4.	Subtrahieren von 32
5.	Subtrahieren von 6
6.	Subtrahieren von 14
7.	18 hinzufügen
8.	33 hinzufügen
9.	34 hinzufügen
10.	Subtrahieren von 26
11.	Subtrahieren von 9

1-10	91	82	73	64	55	45	36	27	18	9
11	0									