Stelle fest, welche Regel die Funktionsmaschine anwendet.

Bsp)

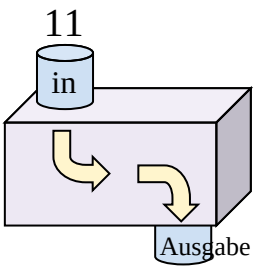

20 hinzufügen

1)

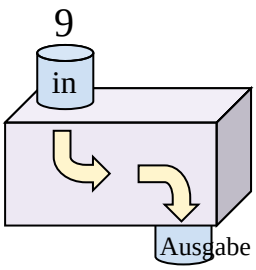

2)

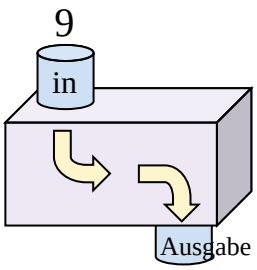

3)

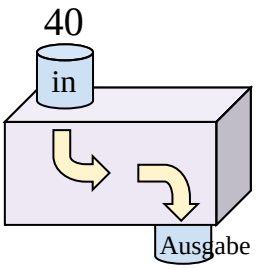

4)

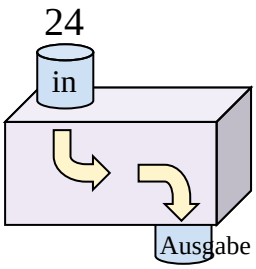

5)

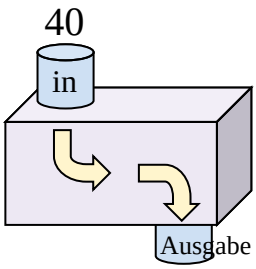

6)

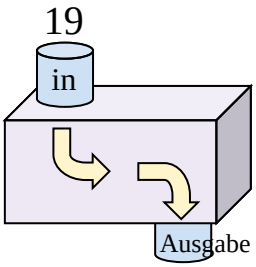

7)

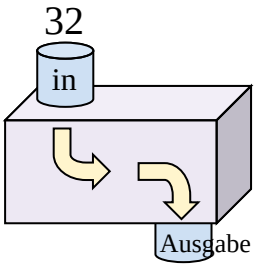

8)

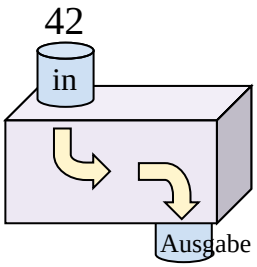

9)

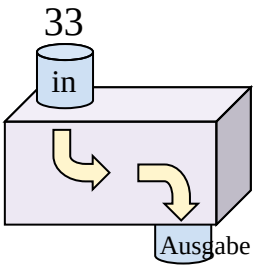

10)

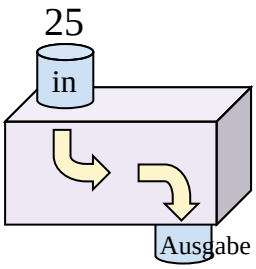

11)

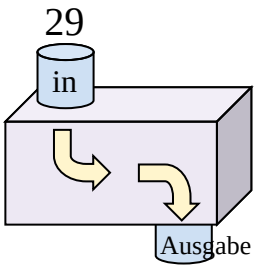

Antworten

Bsp. 20 hinzufügen

1. _____
2. _____
3. _____
4. _____
5. _____
6. _____
7. _____
8. _____
9. _____
10. _____
11. _____

1-10	91	82	73	64	55	45	36	27	18	9
11	0									

Addieren und Subtrahieren

Name: **Lösungsschlüssel**

Stelle fest, welche Regel die Funktionsmaschine anwendet.

Bsp)

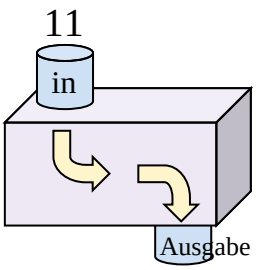

20 hinzufügen

1)

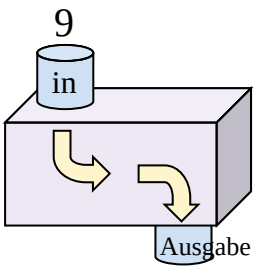

27 hinzufügen

2)

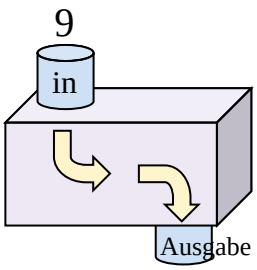

25 hinzufügen

3)

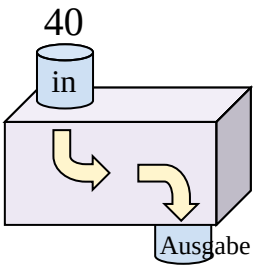

Subtrahieren von 28

4)

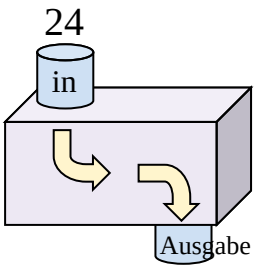

Subtrahieren von 6

5)

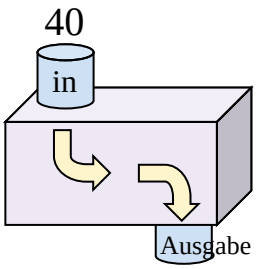

Subtrahieren von 34

6)

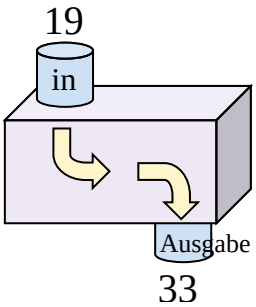

14 hinzufügen

7)

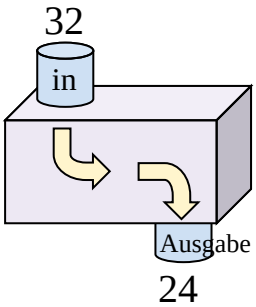

Subtrahieren von 8

8)

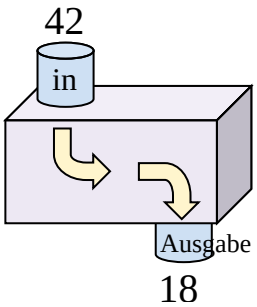

Subtrahieren von 24

9)

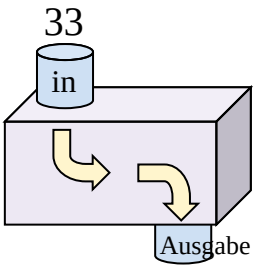

Subtrahieren von 25

10)

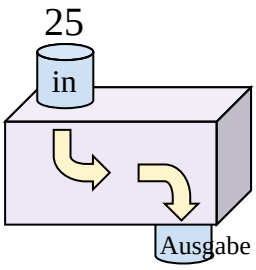

14 hinzufügen

11)

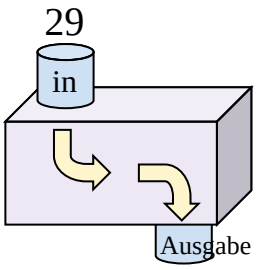

9 hinzufügen

Antworten

Bsp.	20 hinzufügen
1.	27 hinzufügen
2.	25 hinzufügen
3.	Subtrahieren von 28
4.	Subtrahieren von 6
5.	Subtrahieren von 34
6.	14 hinzufügen
7.	Subtrahieren von 8
8.	Subtrahieren von 24
9.	Subtrahieren von 25
10.	14 hinzufügen
11.	9 hinzufügen

1-10	91	82	73	64	55	45	36	27	18	9
11	0									