Umwandeln von Multiplikationsaufgaben

Name:

Schreibe jede Anordnung als eine Multiplikationsaufgabe um und löse sie.

Bsp)

1)



2)



3)



4)

5)

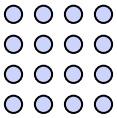

6)

7)

8)

9)



10)

11)

Antworten

Bsp. **6 • 8 = 48**

1. _____
2. _____
3. _____
4. _____
5. _____
6. _____
7. _____
8. _____
9. _____
10. _____
11. _____

Umwandeln von Multiplikationsaufgaben

Name: **Lösungsschlüssel**

Schreibe jede Anordnung als eine Multiplikationsaufgabe um und löse sie.

Bsp)

1)



2)



3)



4)

5)

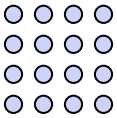

6)

7)

8)

9)



10)

11)

Antworten

Bsp.	6 • 8 = 48
1.	10 • 6 = 60
2.	10 • 5 = 50
3.	5 • 10 = 50
4.	7 • 5 = 35
5.	4 • 4 = 16
6.	3 • 3 = 9
7.	4 • 10 = 40
8.	10 • 4 = 40
9.	7 • 7 = 49
10.	4 • 3 = 12
11.	6 • 4 = 24