Umwandeln von Multiplikationsaufgaben

Name:

Schreibe jede Anordnung als eine Multiplikationsaufgabe um und löse sie.

Bsp)



1)

2)



3)

4)



5)



6)

7)



8)

9)



10)



11)

Antworten

Bsp. 7 • 8 = 56

1. _____
2. _____
3. _____
4. _____
5. _____
6. _____
7. _____
8. _____
9. _____
10. _____
11. _____

Umwandeln von Multiplikationsaufgaben Name: **Lösungsschlüssel**

Schreibe jede Anordnung als eine Multiplikationsaufgabe um und löse sie.

Bsp)



1)

2)



3)

4)



5)



6)

7)



8)

9)



10)



11)

Antworten

Bsp.	7 • 8 = 56
1.	8 • 9 = 72
2.	3 • 7 = 21
3.	2 • 3 = 6
4.	4 • 8 = 32
5.	4 • 3 = 12
6.	8 • 3 = 24
7.	8 • 10 = 80
8.	6 • 2 = 12
9.	6 • 7 = 42
10.	5 • 7 = 35
11.	4 • 4 = 16