Umwandeln von Multiplikationsaufgaben

Name:

Schreibe jede Anordnung als eine Multiplikationsaufgabe um und löse sie.

Bsp)

1)

2)



3)

4)

5)

6)



7)



8)

9)



10)

11)



Antworten

Bsp. **9 • 5 = 45**

1. _____
2. _____
3. _____
4. _____
5. _____
6. _____
7. _____
8. _____
9. _____
10. _____
11. _____

1-10	91	82	73	64	55	45	36	27	18	9
11	0									

Umwandeln von Multiplikationsaufgaben Name: **Lösungsschlüssel**

Schreibe jede Anordnung als eine Multiplikationsaufgabe um und löse sie.

Bsp)

1)

2)



3)

4)

5)

6)



7)



8)

9)



10)

11)



Antworten

Bsp.	9 • 5 = 45
1.	8 • 2 = 16
2.	6 • 9 = 54
3.	3 • 7 = 21
4.	2 • 9 = 18
5.	3 • 4 = 12
6.	8 • 10 = 80
7.	10 • 9 = 90
8.	2 • 10 = 20
9.	4 • 2 = 8
10.	3 • 6 = 18
11.	10 • 5 = 50

1-10	91	82	73	64	55	45	36	27	18	9
11	0									