Umwandeln von Multiplikationsaufgaben

Name:

Schreibe jede Anordnung als eine Multiplikationsaufgabe um und löse sie.

Bsp)



1)

2)



3)

4)



5)



6)



7)



8)



9)



10)



11)

Antworten

Bsp. 7 • 7 = 49

1. _____
2. _____
3. _____
4. _____
5. _____
6. _____
7. _____
8. _____
9. _____
10. _____
11. _____

1-10	91	82	73	64	55	45	36	27	18	9
11	0									

Umwandeln von Multiplikationsaufgaben Name: **Lösungsschlüssel**

Schreibe jede Anordnung als eine Multiplikationsaufgabe um und löse sie.

Bsp)



1)

2)



3)

4)



5)



6)



7)



8)



9)



10)



11)

Antworten

Bsp.	7 • 7 = 49
1.	8 • 6 = 48
2.	6 • 8 = 48
3.	5 • 2 = 10
4.	10 • 8 = 80
5.	8 • 2 = 16
6.	9 • 10 = 90
7.	3 • 8 = 24
8.	8 • 9 = 72
9.	3 • 9 = 27
10.	9 • 9 = 81
11.	6 • 4 = 24

1-10	91	82	73	64	55	45	36	27	18	9
11	0									