Umwandeln von Multiplikationsaufgaben

Name:

Schreibe jede Anordnung als eine Multiplikationsaufgabe um und löse sie.

Bsp)

1)



2)



3)

4)



5)

6)

7)

8)



9)



10)

11)

Antworten

Bsp. **9 • 6 = 54**

1. _____
2. _____
3. _____
4. _____
5. _____
6. _____
7. _____
8. _____
9. _____
10. _____
11. _____

1-10	91	82	73	64	55	45	36	27	18	9
11	0									

Umwandeln von Multiplikationsaufgaben Name: **Lösungsschlüssel**

Schreibe jede Anordnung als eine Multiplikationsaufgabe um und löse sie.

Bsp)

1)



2)



3)

4)



5)

6)

7)

8)



9)



10)

11)

Antworten

Bsp.	9 • 6 = 54
1.	7 • 6 = 42
2.	7 • 10 = 70
3.	8 • 2 = 16
4.	4 • 2 = 8
5.	4 • 8 = 32
6.	3 • 2 = 6
7.	10 • 7 = 70
8.	4 • 10 = 40
9.	3 • 6 = 18
10.	7 • 5 = 35
11.	4 • 6 = 24

1-10	91	82	73	64	55	45	36	27	18	9
11	0									