Multiplikationsaufgaben umschreiben

Name:

Stelle fest, wie man die gezeigten Gruppen als eine Multiplikationsaufgabe ausdrücken könnte.

Bsp)



1)

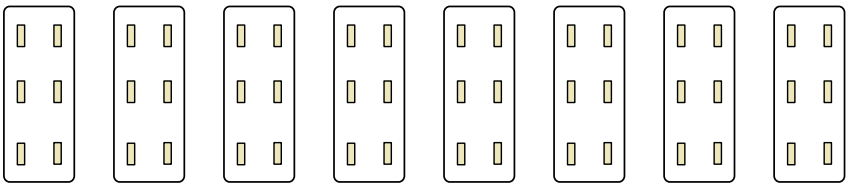

2)

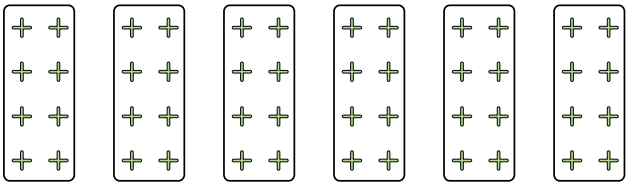

3)



4)

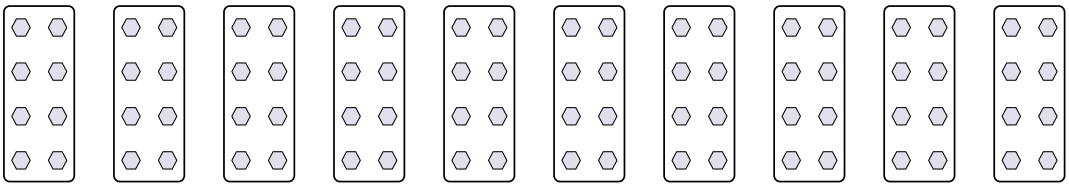

5)

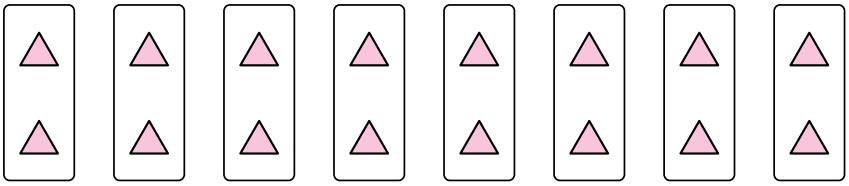

6)

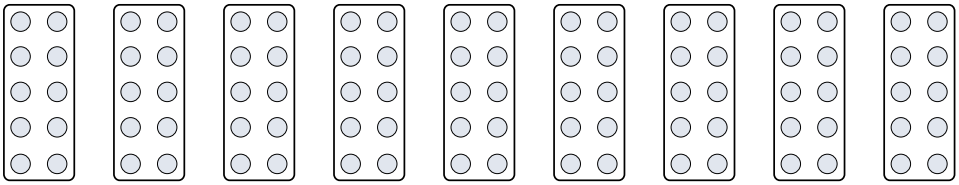

7)



8)

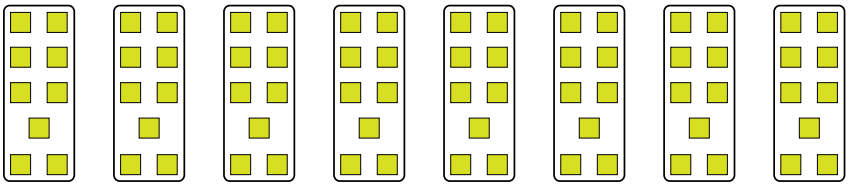

Antworten

Bsp. 7•7=49

1. _____
2. _____
3. _____
4. _____
5. _____
6. _____
7. _____
8. _____

1-8	88	75	63	50	38	25	13	0

Multiplikationsaufgaben umschreiben

Name: **Lösungsschlüssel**

Stelle fest, wie man die gezeigten Gruppen als eine Multiplikationsaufgabe ausdrücken könnte.

Bsp)



1)

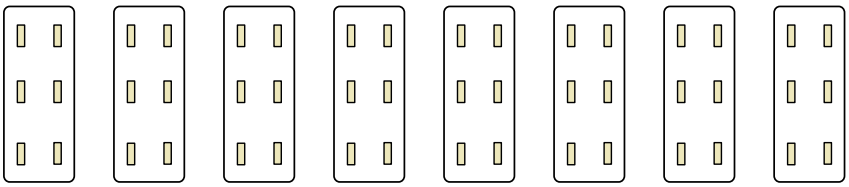

2)

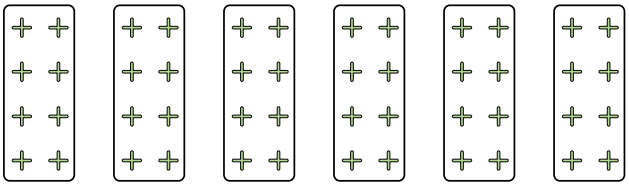

3)



4)

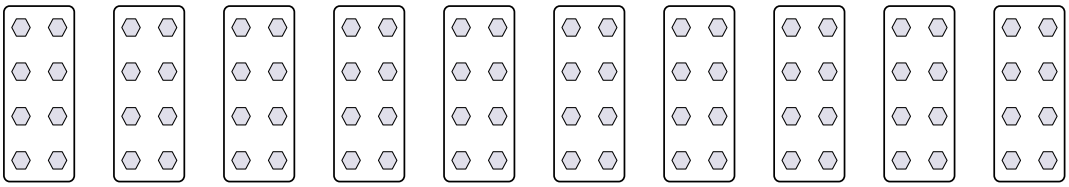

5)

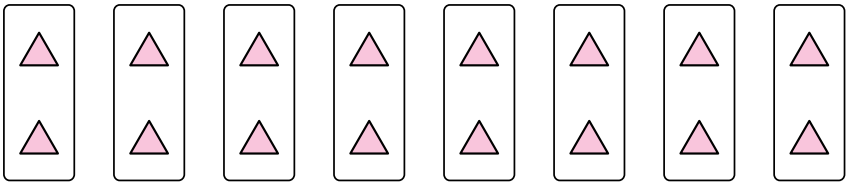

6)

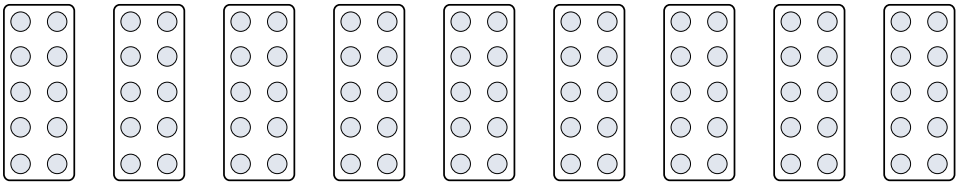

7)



8)

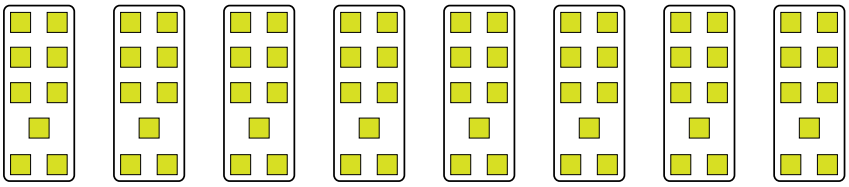

Antworten

Bsp. **7•7=49**

1. **8•6=48**
2. **6•8=48**
3. **5•2=10**
4. **10•8=80**
5. **8•2=16**
6. **9•10=90**
7. **3•8=24**
8. **8•9=72**

1-8	88	75	63	50	38	25	13	0