Identifizieren von Münzen

Name:

Zählen Sie die Anzahl der Viertel (25¢), Dimes (10¢), Nickels (5¢) und Pennies (1¢).

Bsp)

1)

2)

3)

4) 

5)

6)

7)

8)

9)

10)

Antworten

Bsp.	2	3	2	2
1.				
2.				
3.				
4.				
5.				
6.				
7.				
8.				
9.				
10.				

1-10	90	80	70	60	50	40	30	20	10	0

Identifizieren von Münzen

Name: **Lösungsschlüssel**

Zählen Sie die Anzahl der Viertel (25¢), Dimes (10¢), Nickels (5¢) und Pennies (1¢).

Bsp)

1)

2)

3)

4)



5)

6)

7)

8)

9)

10)

Antworten

Bsp.	2	3	2	2
1.	3	2	1	3
2.	2	2	2	3
3.	3	2	2	2
4.	2	2	2	3
5.	2	2	3	2
6.	2	2	4	1
7.	1	4	2	2
8.	3	1	2	3
9.	3	2	2	2
10.	1	4	3	1

1-10	90	80	70	60	50	40	30	20	10	0

Identifizieren von Münzen

Name:

Zählen Sie die Anzahl der Viertel (25¢), Dimes (10¢), Nickels (5¢) und Pennies (1¢).

Bsp)

1)



2)



3)

4)

5)



6)

7)

8)

9)

10)

Antworten

Bsp.	1	1	4	3
1.				
2.				
3.				
4.				
5.				
6.				
7.				
8.				
9.				
10.				

1-10	90	80	70	60	50	40	30	20	10	0

Identifizieren von Münzen

Name: **Lösungsschlüssel**

Zählen Sie die Anzahl der Viertel (25¢), Dimes (10¢), Nickels (5¢) und Pennies (1¢).

Bsp)

1)



2)



3)

4)

5)



6)

7)

8)

9)

10)

Antworten

Bsp.	1	1	4	3
1.	3	2	1	3
2.	3	2	2	2
3.	2	2	2	3
4.	1	3	3	2
5.	1	2	2	4
6.	2	2	3	2
7.	4	2	2	1
8.	3	3	1	2
9.	1	2	4	2
10.	1	2	3	3

1-10	90	80	70	60	50	40	30	20	10	0

Identifizieren von Münzen

Name:

Zählen Sie die Anzahl der Viertel (25¢), Dimes (10¢), Nickels (5¢) und Pennies (1¢).

Bsp)

1)

2)



3)

4)

5)

6)

7)

8)

9)

10)

Antworten

Bsp.	3	2	2	2
1.				
2.				
3.				
4.				
5.				
6.				
7.				
8.				
9.				
10.				

1-10	90	80	70	60	50	40	30	20	10	0

Identifizieren von Münzen

Name: **Lösungsschlüssel**

Zählen Sie die Anzahl der Viertel (25¢), Dimes (10¢), Nickels (5¢) und Pennies (1¢).

Bsp)

1)

2)



3)



4)

5)

6)

7)

8)

9)

10)

Antworten

Bsp.	3	2	2	2
1.	2	2	3	2
2.	2	2	2	3
3.	2	5	1	1
4.	2	3	2	2
5.	2	2	2	3
6.	2	4	1	2
7.	3	1	1	4
8.	3	2	2	2
9.	3	2	1	3
10.	1	2	2	4

1-10	90	80	70	60	50	40	30	20	10	0

Identifizieren von Münzen

Name:

Zählen Sie die Anzahl der Viertel (25¢), Dimes (10¢), Nickels (5¢) und Pennies (1¢).

Bsp) 

1)

2)

3)

4)

5)

6) 

7)

8)

9)

10)

Antworten

Bsp.	3	2	1	3
1.				
2.				
3.				
4.				
5.				
6.				
7.				
8.				
9.				
10.				

1-10	90	80	70	60	50	40	30	20	10	0

Identifizieren von Münzen

Name: **Lösungsschlüssel**

Zählen Sie die Anzahl der Viertel (25¢), Dimes (10¢), Nickels (5¢) und Pennies (1¢).

Bsp)



1)

2)



3)

4)

5)

6)

7)

8)

9)

10)

Antworten

Bsp.	3	2	1	3
1.	2	3	3	1
2.	1	3	3	2
3.	2	2	2	3
4.	3	2	2	2
5.	2	4	1	2
6.	2	2	3	2
7.	2	2	3	2
8.	2	1	3	3
9.	2	4	1	2
10.	1	3	1	4

1-10	90	80	70	60	50	40	30	20	10	0

Identifizieren von Münzen

Name:

Zählen Sie die Anzahl der Viertel (25¢), Dimes (10¢), Nickels (5¢) und Pennies (1¢).

Bsp)



1)

2)

3)

4)



5)

6)



7)

8)

9)



10)

Antworten

Bsp.	2	2	2	3
1.				
2.				
3.				
4.				
5.				
6.				
7.				
8.				
9.				
10.				

1-10	90	80	70	60	50	40	30	20	10	0

Identifizieren von Münzen

Name: **Lösungsschlüssel**

Zählen Sie die Anzahl der Viertel (25¢), Dimes (10¢), Nickels (5¢) und Pennies (1¢).

Bsp)



1)

2)

3)

4)



5)

6)



7)

8)

9)



10)

Antworten

Bsp.	2	2	2	3
1.	5	1	1	2
2.	2	2	2	3
3.	1	5	2	1
4.	3	1	2	3
5.	3	2	2	2
6.	3	2	2	2
7.	2	2	3	2
8.	2	3	2	2
9.	2	3	2	2
10.	1	4	3	1

1-10	90	80	70	60	50	40	30	20	10	0

Identifizieren von Münzen

Name:

Zählen Sie die Anzahl der Viertel (25¢), Dimes (10¢), Nickels (5¢) und Pennies (1¢).

Bsp)

1)

2)

3)

4)

5)



6)

7)

8)

9)

10)

Antworten

Bsp.	2	2	3	2
1.				
2.				
3.				
4.				
5.				
6.				
7.				
8.				
9.				
10.				

1-10	90	80	70	60	50	40	30	20	10	0

Identifizieren von Münzen

Name: **Lösungsschlüssel**

Zählen Sie die Anzahl der Viertel (25¢), Dimes (10¢), Nickels (5¢) und Pennies (1¢).

Bsp)

1)

2)

3)

4)

5)



6)

7)

8)

9)

10)

Antworten

Bsp.	2	2	3	2
1.	2	2	3	2
2.	3	3	2	1
3.	2	2	2	3
4.	3	4	1	1
5.	4	2	1	2
6.	1	2	3	3
7.	2	3	1	3
8.	2	2	3	2
9.	2	2	2	3
10.	2	2	2	3

1-10	90	80	70	60	50	40	30	20	10	0

Identifizieren von Münzen

Name:

Zählen Sie die Anzahl der Viertel (25¢), Dimes (10¢), Nickels (5¢) und Pennies (1¢).

Bsp)



1)



2)

3)

4)

5)

6)

7)

8)

9)

10)

Antworten

Bsp.	2	1	2	4
1.				
2.				
3.				
4.				
5.				
6.				
7.				
8.				
9.				
10.				

1-10	90	80	70	60	50	40	30	20	10	0

Identifizieren von Münzen

Name: **Lösungsschlüssel**

Zählen Sie die Anzahl der Viertel (25¢), Dimes (10¢), Nickels (5¢) und Pennies (1¢).

Bsp)



1)



2)

3)

4)

5)

6)

7)

8)

9)

10)

Antworten

Bsp.	2	1	2	4
1.	2	1	3	3
2.	1	2	3	3
3.	3	4	1	1
4.	2	2	3	2
5.	3	1	2	3
6.	1	4	2	2
7.	3	2	2	2
8.	2	3	1	3
9.	2	3	3	1
10.	1	3	4	1

1-10	90	80	70	60	50	40	30	20	10	0

Identifizieren von Münzen

Name:

Zählen Sie die Anzahl der Viertel (25¢), Dimes (10¢), Nickels (5¢) und Pennies (1¢).

Bsp)



1)



2)

3)

4)

5)



6)

7)

8)

9)

10)

Antworten

Bsp.	1	2	3	3
1.				
2.				
3.				
4.				
5.				
6.				
7.				
8.				
9.				
10.				

1-10	90	80	70	60	50	40	30	20	10	0

Identifizieren von Münzen

Name: **Lösungsschlüssel**

Zählen Sie die Anzahl der Viertel (25¢), Dimes (10¢), Nickels (5¢) und Pennies (1¢).

Bsp)



1)



2)

3)

4)

5)



6)

7)

8)

9)

10)

Antworten

Bsp.	1	2	3	3
1.	3	1	3	2
2.	2	2	2	3
3.	2	3	1	3
4.	2	3	2	2
5.	2	3	2	2
6.	3	3	1	2
7.	2	3	2	2
8.	2	2	3	2
9.	2	3	2	2
10.	2	2	3	2

1-10	90	80	70	60	50	40	30	20	10	0

Identifizieren von Münzen

Name:

Zählen Sie die Anzahl der Viertel (25¢), Dimes (10¢), Nickels (5¢) und Pennies (1¢).

Bsp)

1)

2)

3)

4)

5)

6)

7)

8)

9)

10)

Antworten

Bsp.	1	2	3	3
1.				
2.				
3.				
4.				
5.				
6.				
7.				
8.				
9.				
10.				

1-10	90	80	70	60	50	40	30	20	10	0

Identifizieren von Münzen

Name: **Lösungsschlüssel**

Zählen Sie die Anzahl der Viertel (25¢), Dimes (10¢), Nickels (5¢) und Pennies (1¢).

Bsp)

1)

2)

3)

4)

5)

6)

7)

8)

9)



10)

Antworten

Bsp.	1	2	3	3
1.	2	2	3	2
2.	2	2	2	3
3.	3	3	1	2
4.	2	2	3	2
5.	1	3	3	2
6.	2	1	3	3
7.	3	3	2	1
8.	4	2	2	1
9.	2	2	3	2
10.	1	5	1	2

1-10	90	80	70	60	50	40	30	20	10	0

Identifizieren von Münzen

Name:

Zählen Sie die Anzahl der Viertel (25¢), Dimes (10¢), Nickels (5¢) und Pennies (1¢).

Bsp)

1)



2)

3)

4)

5)

6)

7)

8)

9)



10)

Antworten

Bsp.	3	1	3	2
1.				
2.				
3.				
4.				
5.				
6.				
7.				
8.				
9.				
10.				

1-10	90	80	70	60	50	40	30	20	10	0

Identifizieren von Münzen

Name: **Lösungsschlüssel**

Zählen Sie die Anzahl der Viertel (25¢), Dimes (10¢), Nickels (5¢) und Pennies (1¢).

Bsp)

1)



2)

3)

4)

5)

6)

7)

8)

9)



10)

Antworten

Bsp.	3	1	3	2
1.	2	2	2	3
2.	2	3	2	2
3.	1	4	2	2
4.	1	3	1	4
5.	1	3	3	2
6.	1	4	2	2
7.	3	3	2	1
8.	3	3	2	1
9.	2	3	2	2
10.	2	2	3	2

1-10	90	80	70	60	50	40	30	20	10	0