Identifizieren von Münzen

Name:

Zählen Sie die Anzahl der Viertel (25¢), Dimes (10¢), Nickels (5¢) und Pennies (1¢).

Bsp)



1)



2)

3)

4)

5)



6)

7)

8)

9)

10)

Antworten

Bsp.	1	2	3	3
1.				
2.				
3.				
4.				
5.				
6.				
7.				
8.				
9.				
10.				

1-10	90	80	70	60	50	40	30	20	10	0

Identifizieren von Münzen

Name: **Lösungsschlüssel**

Zählen Sie die Anzahl der Viertel (25¢), Dimes (10¢), Nickels (5¢) und Pennies (1¢).

Bsp)



1)



2)

3)

4)

5)



6)

7)

8)

9)

10)

Antworten

Bsp.	1	2	3	3
1.	3	1	3	2
2.	2	2	2	3
3.	2	3	1	3
4.	2	3	2	2
5.	2	3	2	2
6.	3	3	1	2
7.	2	3	2	2
8.	2	2	3	2
9.	2	3	2	2
10.	2	2	3	2

1-10	90	80	70	60	50	40	30	20	10	0