Ungleichheiten auf einem Zahlenstrahl

Name:

Benutze den Zahlenstrahl, um die Ungleichheit darzustellen.

Bsp) $X \leq -125$

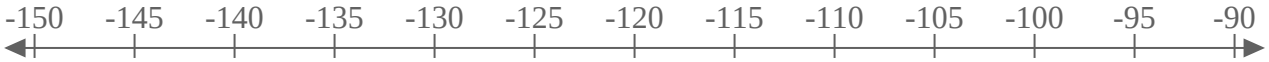

1) $X > -98$

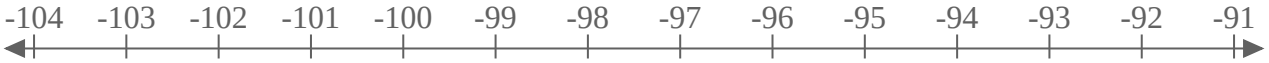

2) $X \leq -60$

3) $X < 45$

4) $X > -7$

5) $X \leq 130$

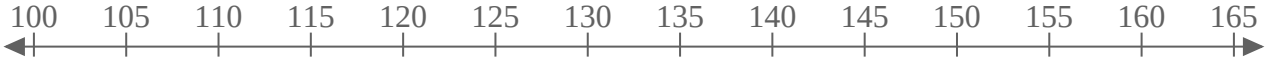

6) $X \leq -40$

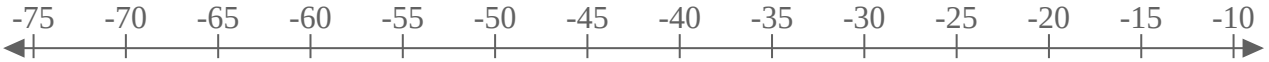

7) $X > -80$

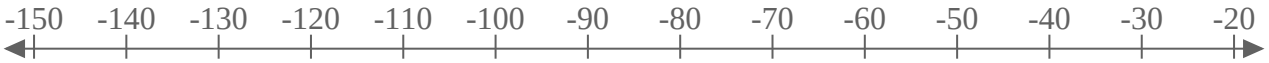

8) $X > 60$

9) $X \geq 115$

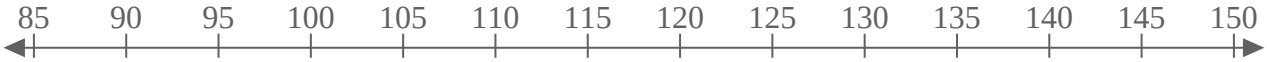

10) $X \geq -20$

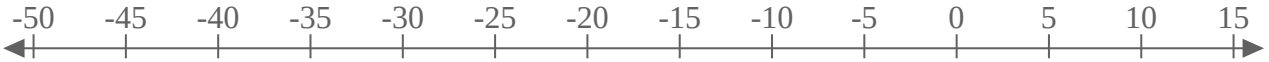

11) $X \geq -25$

12) $X \leq -166$

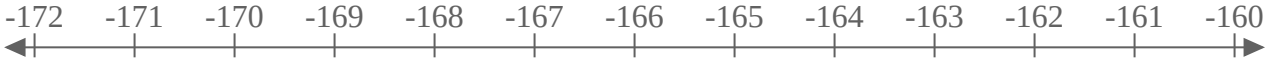

13) $X < 90$

1-10	92	85	77	69	62	54	46	38	31	23
11-13	15	8	0							

Ungleichheiten auf einem Zahlenstrahl Name: **Lösungsschlüssel**

Benutze den Zahlenstrahl, um die Ungleichheit darzustellen.

Bsp) $X \leq -125$

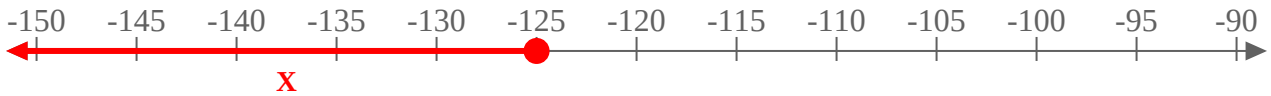

1) $X > -98$

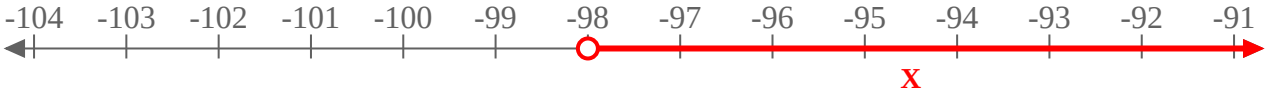

2) $X \leq -60$

3) $X < 45$

4) $X > -7$

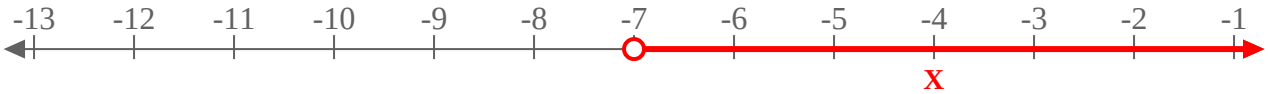

5) $X \leq 130$

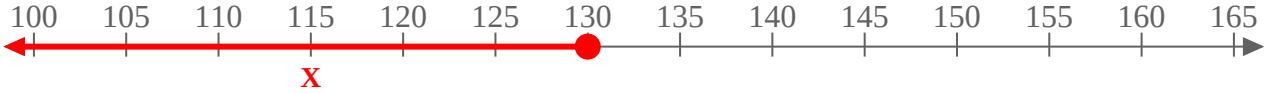

6) $X \leq -40$

7) $X > -80$

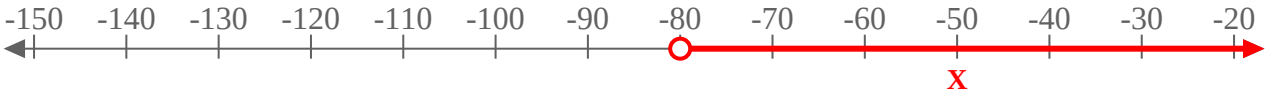

8) $X > 60$

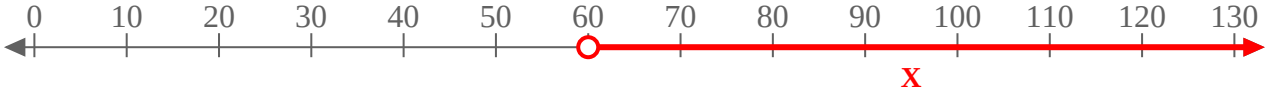

9) $X \geq 115$

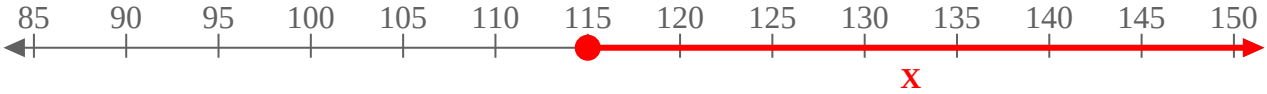

10) $X \geq -20$

11) $X \geq -25$

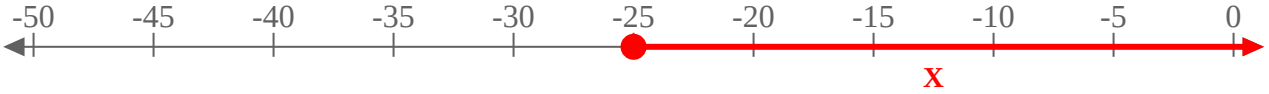

12) $X \leq -166$

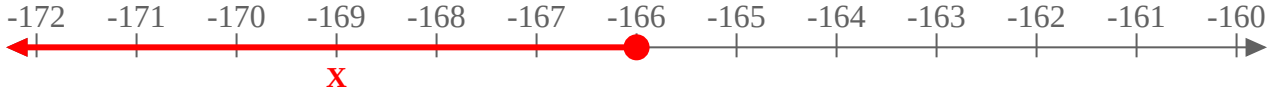

13) $X < 90$

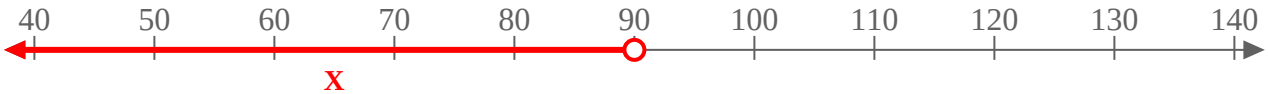

1-10	92	85	77	69	62	54	46	38	31	23
11-13	15	8	0							