Identifizieren derselben Steigung

Name:

Bestimmen Sie, welche Wahl die gleiche Steigung wie die gezeigte hat.

1)

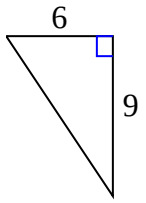

A.

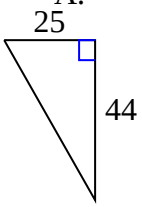

B.

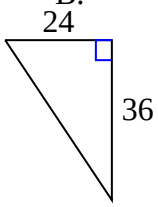

C.

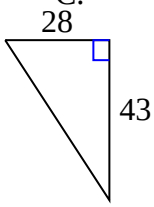

D.

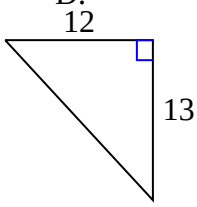

2)

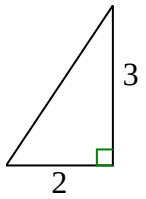

A.

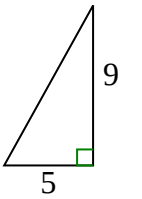

B.

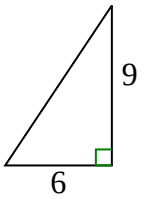

C.

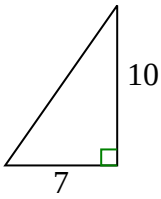

D.

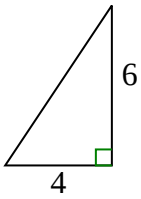

3)

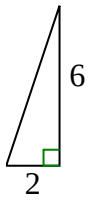

A.

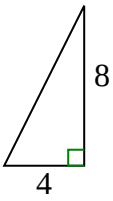

B.

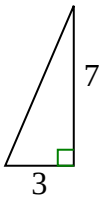

C.

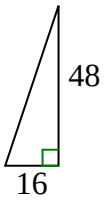

D.

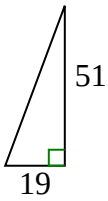

4)

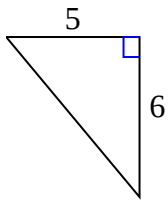

A.

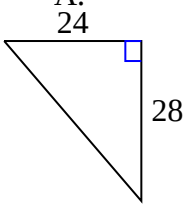

B.

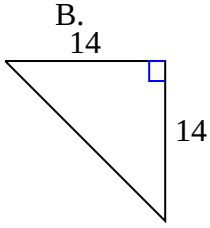

C.

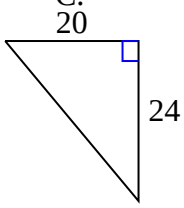

D.

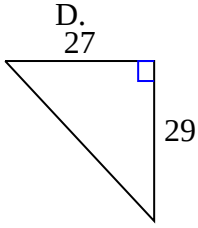

5)

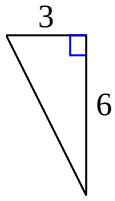

A.

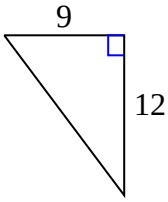

B.

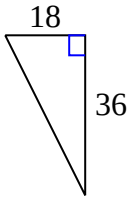

C.

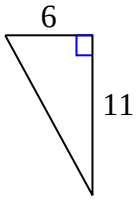

D.

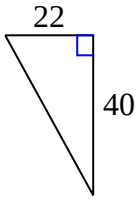

Antworten

1. _____
2. _____
3. _____
4. _____
5. _____

1-5	80	60	40	20	0

Identifizieren derselben Steigung

Name: **Lösungsschlüssel**

Bestimmen Sie, welche Wahl die gleiche Steigung wie die gezeigte hat.

1)

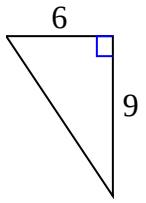

A.

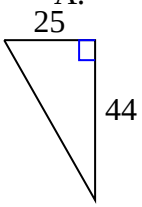

B.

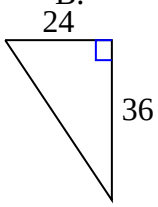

C.

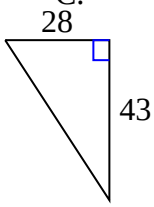

D.

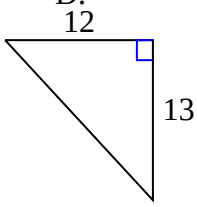

2)

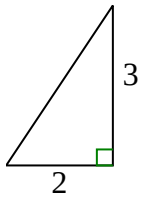

A.

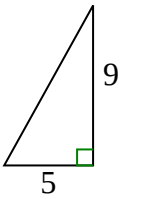

B.

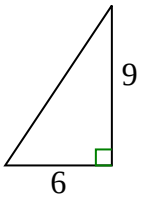

C.

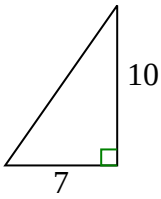

D.

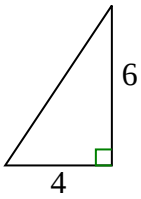

3)

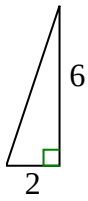

A.

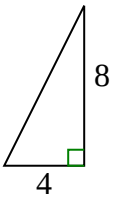

B.

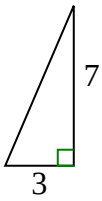

C.

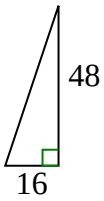

D.

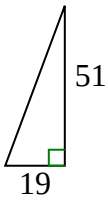

4)

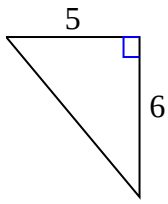

A.

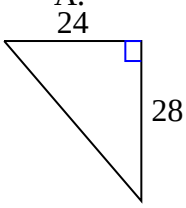

B.

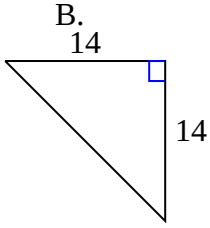

C.

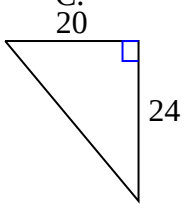

D.

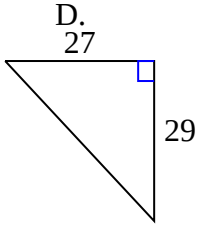

5)

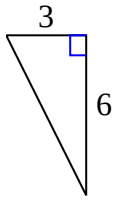

A.

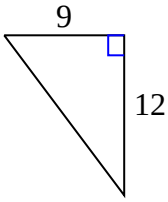

B.

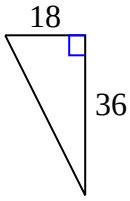

C.

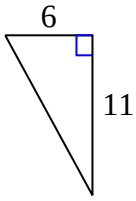

D.

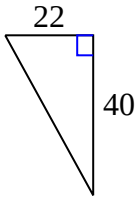

Antworten

1. **B**
2. **D**
3. **C**
4. **C**
5. **B**

1-5	80	60	40	20	0