Erstellen von Rechtecken mit einem Koordinatenraster Name:

Finden Sie die Koordinaten von Punkt D, um ein Rechteck zu erstellen.

Bsp)

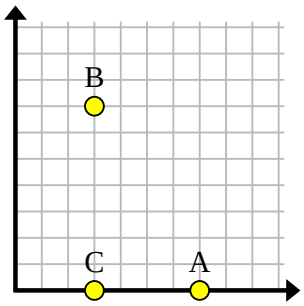

1)

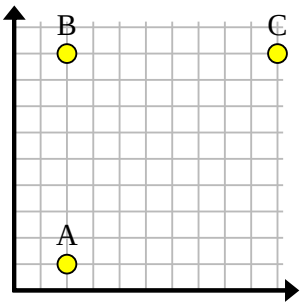

2)

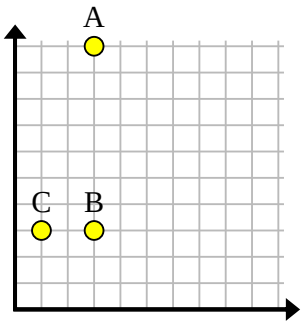

3)

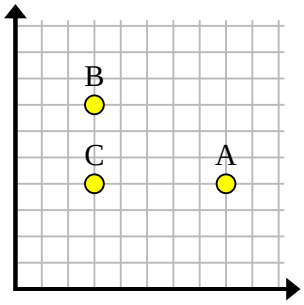

4)

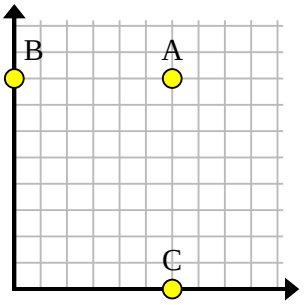

5)

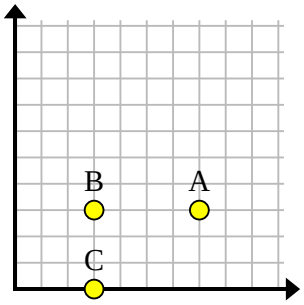

6)

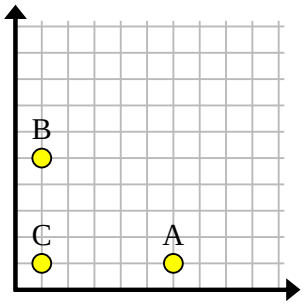

7)

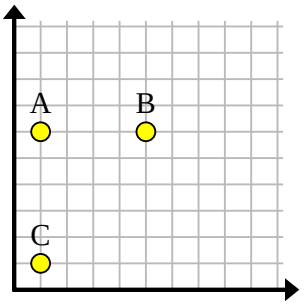

8)

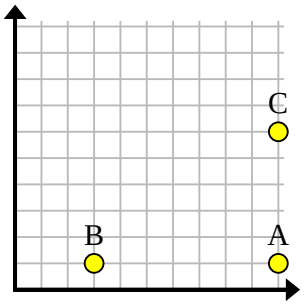

9)

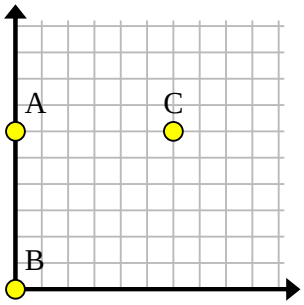

10)

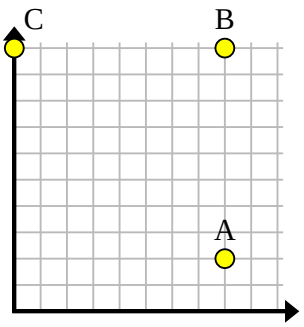

11)

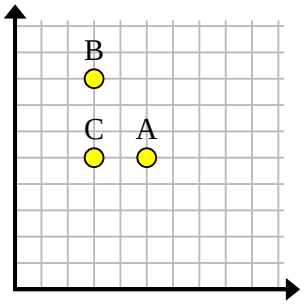

Antworten

Bsp. (7,7)

1. _____
2. _____
3. _____
4. _____
5. _____
6. _____
7. _____
8. _____
9. _____
10. _____
11. _____

1-10	91	82	73	64	55	45	36	27	18	9
11	0									

Erstellen von Rechtecken mit einem Koordinatenraster Name: **Lösungsschlüssel**

Finden Sie die Koordinaten von Punkt D, um ein Rechteck zu erstellen.

Bsp)

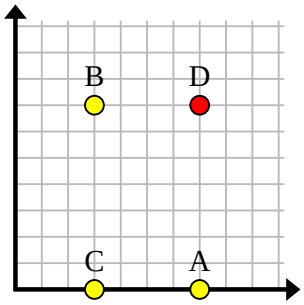

1)

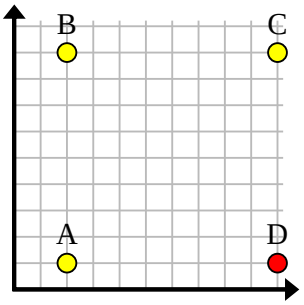

2)

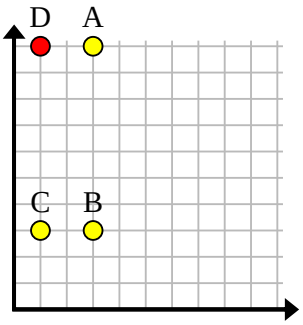

3)

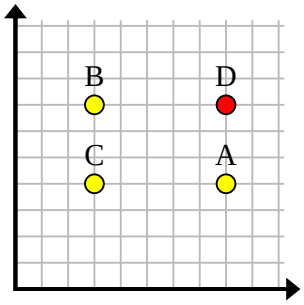

4)

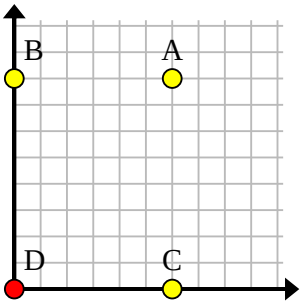

5)

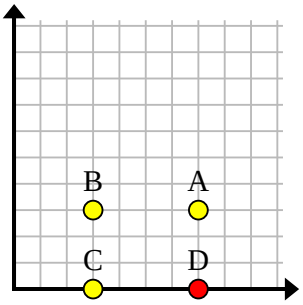

6)

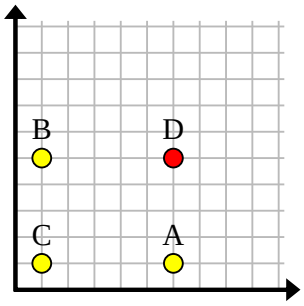

7)

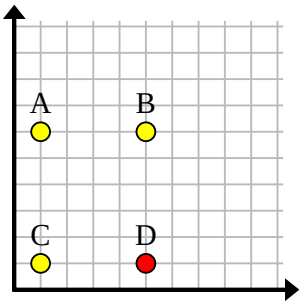

8)

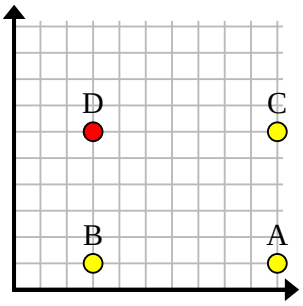

9)

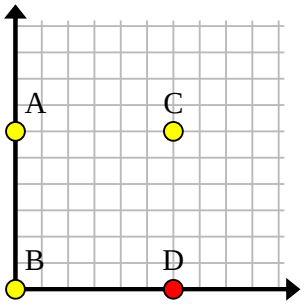

10)

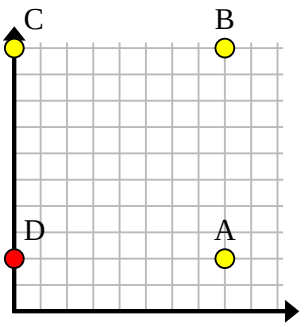

11)

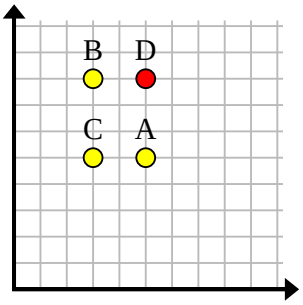

Antworten

Bsp.	(7 , 7)
1.	(10 , 1)
2.	(1 , 10)
3.	(8 , 7)
4.	(0 , 0)
5.	(7 , 0)
6.	(6 , 5)
7.	(5 , 1)
8.	(3 , 6)
9.	(6 , 0)
10.	(0 , 2)
11.	(5 , 8)

1-10	91	82	73	64	55	45	36	27	18	9
11	0									