Gemischte Brüche subtrahieren - visuell

Name:

Wende das visuelle Modell an um jede Aufgabe zu lösen.

$4\,{}^{3}\!/_{5} - 2\,{}^{4}\!/_{5} = ?$

Para resolver un problema de resta de fracciones, una estrategia es sombrear primero la cantidad inicial ($4\,{}^{3}\!/_{5}$)

Em seguida, marque os inteiros (2).

Finalmente, marque la fracción ${}^{4}\!/_{5}$.

Ahora podemos ver que $4\,{}^{3}\!/_{5} - 2\,{}^{4}\!/_{5} = 1\,{}^{4}\!/_{5}$

1) $6\frac{5}{6} - 1\frac{5}{6} =$

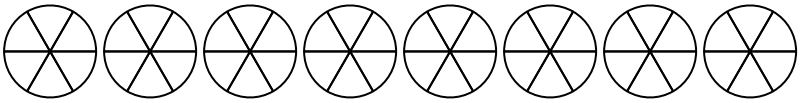

2) $7\frac{2}{10} - 3\frac{7}{10} =$

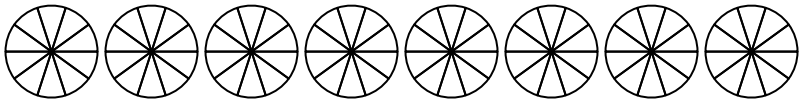

3) $4\frac{9}{10} - 1\frac{1}{10} =$

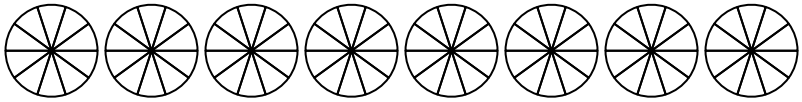

4) $6\frac{7}{8} - 4\frac{1}{8} =$

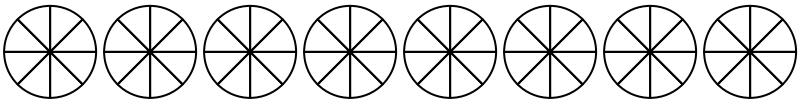

5) $4\frac{5}{12} - 1\frac{8}{12} =$

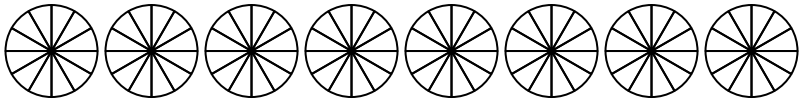

6) $5\frac{4}{10} - 3\frac{2}{10} =$

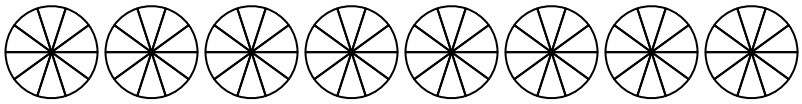

7) $4\frac{8}{12} - 1\frac{8}{12} =$

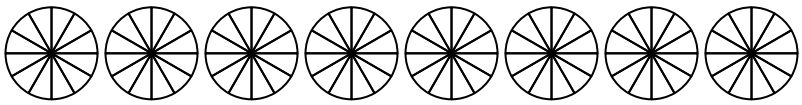

8) $4\frac{7}{8} - 2\frac{4}{8} =$

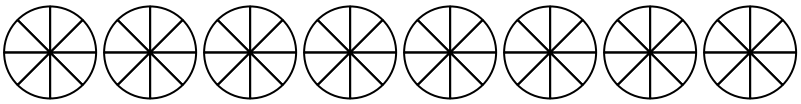

9) $3\frac{2}{3} - 1\frac{2}{3} =$

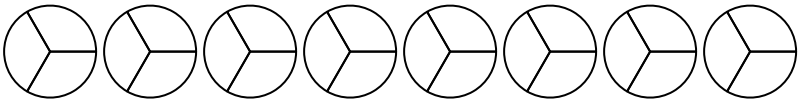

10) $3\frac{1}{3} - 1\frac{2}{3} =$

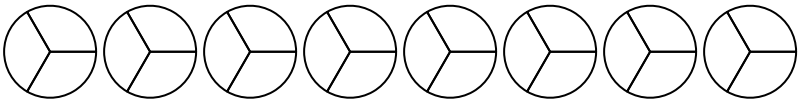

Antworten

1. _____
2. _____
3. _____
4. _____
5. _____
6. _____
7. _____
8. _____
9. _____
10. _____

1-10	90	80	70	60	50	40	30	20	10	0

Gemischte Brüche subtrahieren - visuell

Name: **Lösungsschlüssel**

Wende das visuelle Modell an um jede Aufgabe zu lösen.

$4\frac{3}{5} - 2\frac{4}{5} = ?$

Para resolver un problema de resta de fracciones, una estrategia es sombrear primero la cantidad inicial ($4\frac{3}{5}$)

Em seguida, marque os inteiros (2).

Finalmente, marque la fracción $\frac{4}{5}$.

Ahora podemos ver que $4\frac{3}{5} - 2\frac{4}{5} = 1\frac{4}{5}$

1) $6\frac{5}{6} - 1\frac{5}{6} =$

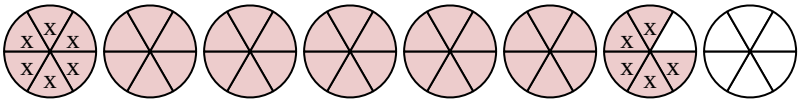

2) $7\frac{2}{10} - 3\frac{7}{10} =$

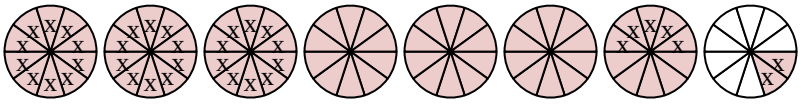

3) $4\frac{9}{10} - 1\frac{1}{10} =$

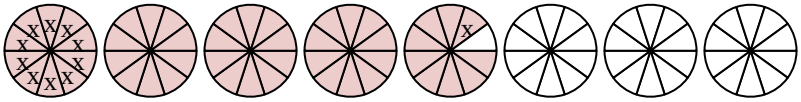

4) $6\frac{7}{8} - 4\frac{1}{8} =$

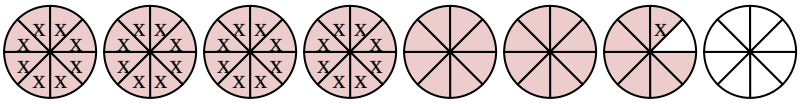

5) $4\frac{5}{12} - 1\frac{8}{12} =$

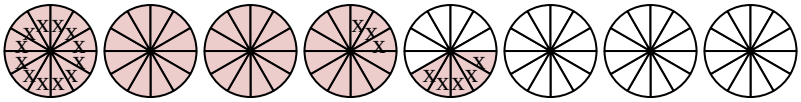

6) $5\frac{4}{10} - 3\frac{2}{10} =$

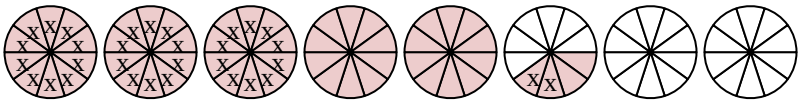

7) $4\frac{8}{12} - 1\frac{8}{12} =$

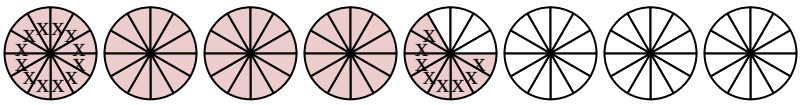

8) $4\frac{7}{8} - 2\frac{4}{8} =$

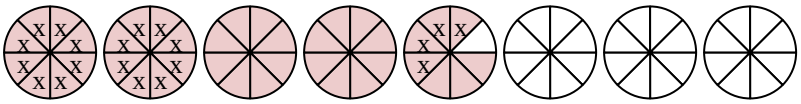

9) $3\frac{2}{3} - 1\frac{2}{3} =$

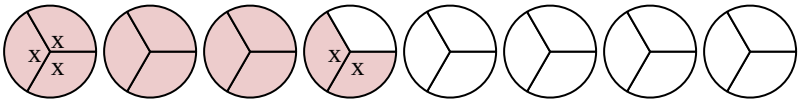

10) $3\frac{1}{3} - 1\frac{2}{3} =$

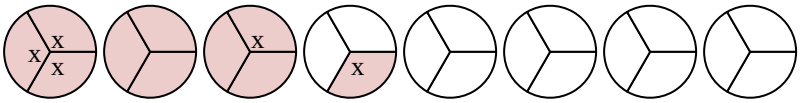

Antworten

1. $5\frac{0}{6}$
2. $3\frac{5}{10}$
3. $3\frac{8}{10}$
4. $2\frac{6}{8}$
5. $2\frac{9}{12}$
6. $2\frac{2}{10}$
7. $3\frac{0}{12}$
8. $2\frac{3}{8}$
9. $2\frac{0}{3}$
10. $1\frac{2}{3}$

1-10	90	80	70	60	50	40	30	20	10	0