Division mit einem Zahlenstrahl

Name:

Benutze den Zahlenstrahl um jede Aufgabe zu lösen. Die erste Aufgabe ist bereíts als Beispiel gelöst.

1) $4:\frac{2}{6}$

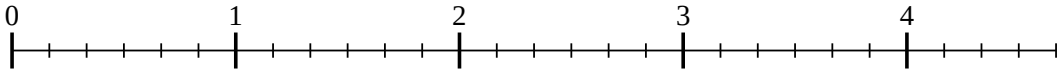

2) $3:\frac{5}{6}$

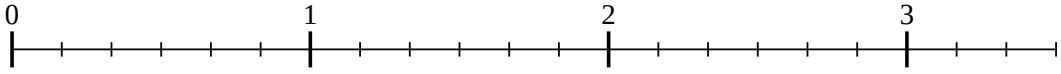

3) $2:\frac{3}{6}$

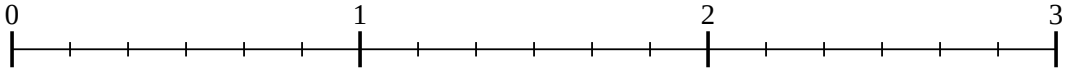

4) $2:\frac{2}{4}$

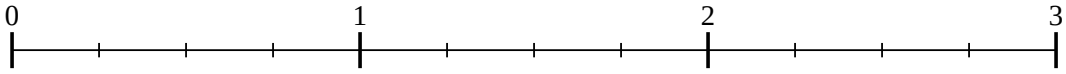

5) $6:\frac{3}{4}$

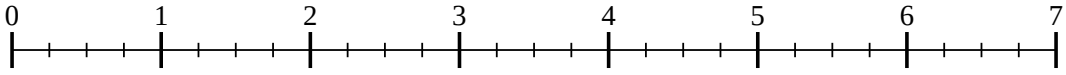

6) $7:\frac{2}{5}$

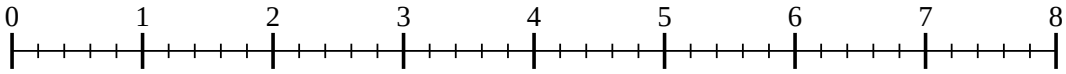

7) $7:\frac{3}{6}$

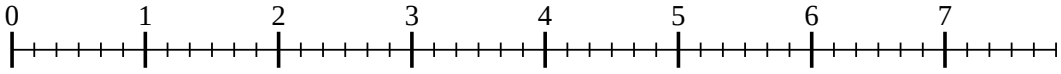

8) $4:\frac{3}{4}$

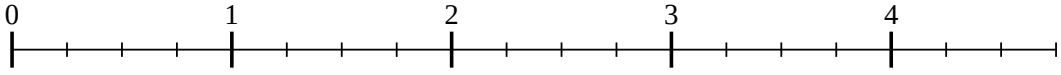

9) $4:\frac{4}{5}$

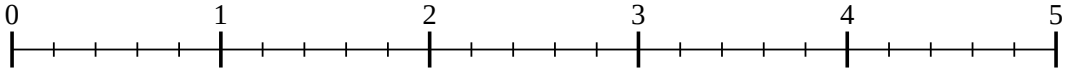

Antworten

1. _____
2. _____
3. _____
4. _____
5. _____
6. _____
7. _____
8. _____
9. _____

1-9	89	78	67	56	44	33	22	11	0

Division mit einem Zahlenstrahl Name: **Lösungsschlüssel**

Benutze den Zahlenstrahl um jede Aufgabe zu lösen. Die erste Aufgabe ist bereits als Beispiel gelöst.

1) $4 : \frac{2}{6}$

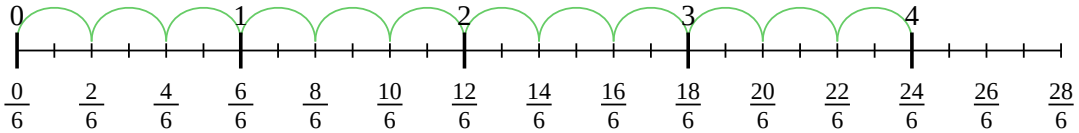

2) $3 : \frac{5}{6}$

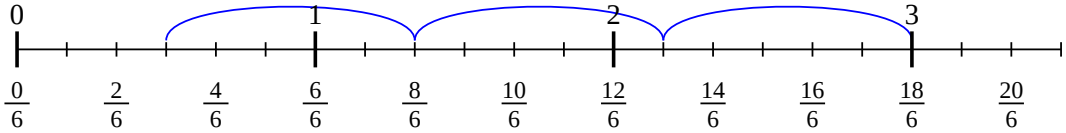

3) $2 : \frac{3}{6}$

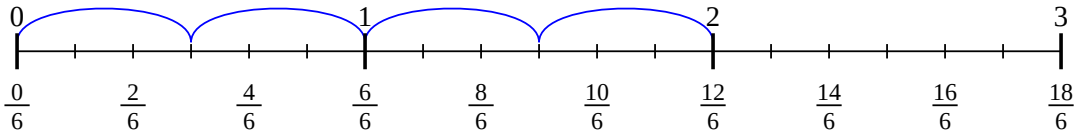

4) $2 : \frac{2}{4}$

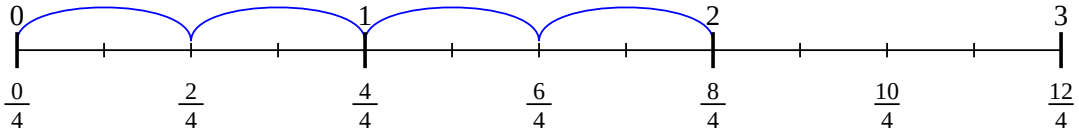

5) $6 : \frac{3}{4}$

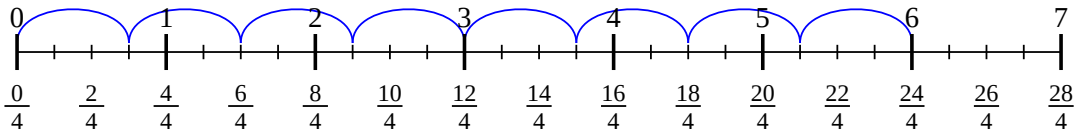

6) $7 : \frac{2}{5}$

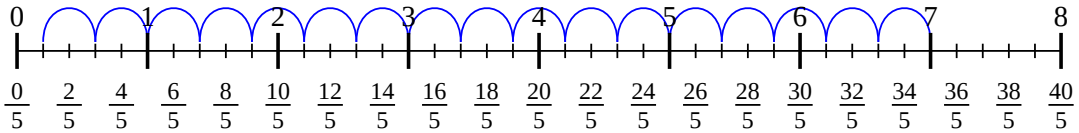

7) $7 : \frac{3}{6}$

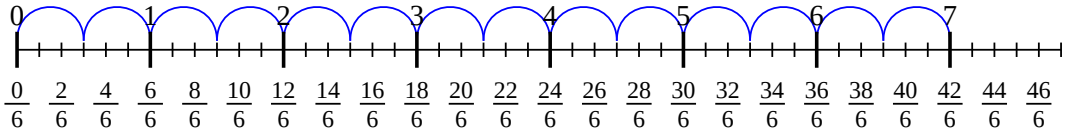

8) $4 : \frac{3}{4}$

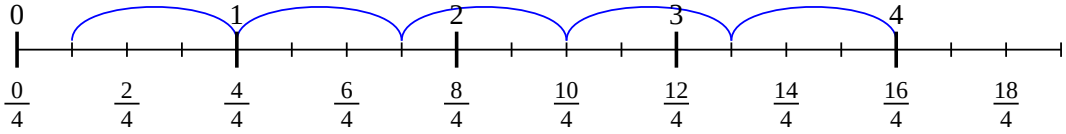

9) $4 : \frac{4}{5}$

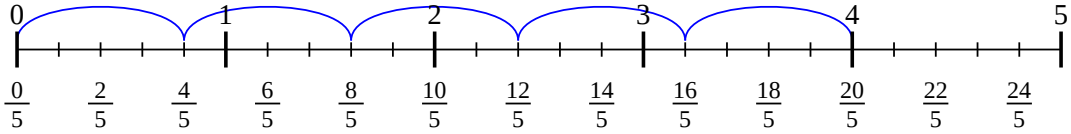

Antworten

1. $\frac{24}{2}$
2. $\frac{18}{5}$
3. $\frac{12}{3}$
4. $\frac{8}{2}$
5. $\frac{24}{3}$
6. $\frac{35}{2}$
7. $\frac{42}{3}$
8. $\frac{16}{3}$
9. $\frac{20}{4}$

1-9	89	78	67	56	44	33	22	11	0