Unechte und gemischte Brüche - visuell

Name:

Schreibe jede Anzahl als eine gemischte Zahl.

1)

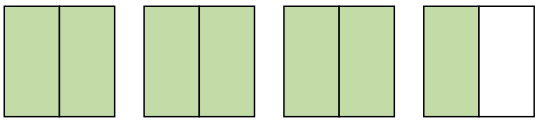

2)

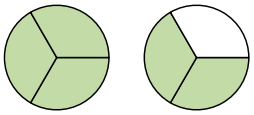

3)

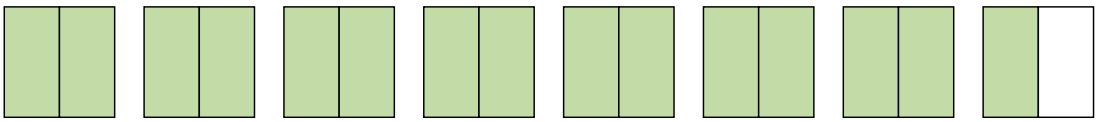

4)

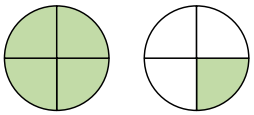

5)

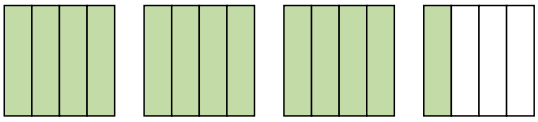

Schreibe jede Anzahl als unechten Bruch.

6)

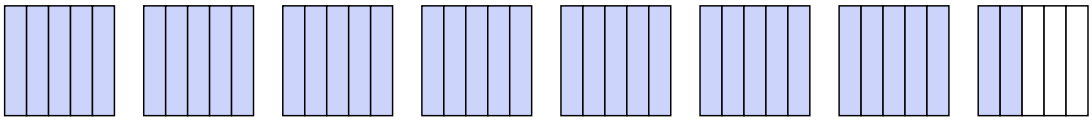

7)

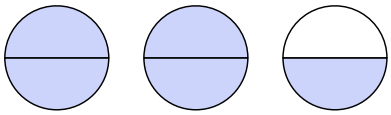

8)

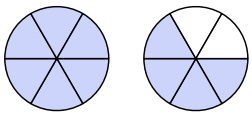

9)

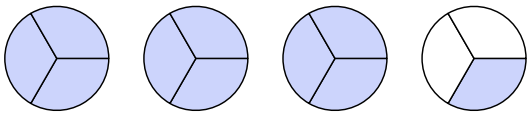

10)

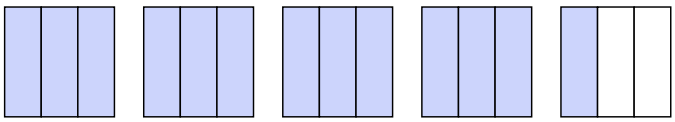

11)

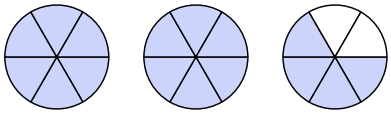

Antworten

1. _____
2. _____
3. _____
4. _____
5. _____
6. _____
7. _____
8. _____
9. _____
10. _____
11. _____

1-10	91	82	73	64	55	45	36	27	18	9
11	0									

Unechte und gemischte Brüche - visuell

Name: **Lösungsschlüssel**

Schreibe jede Anzahl als eine gemischte Zahl.

1)

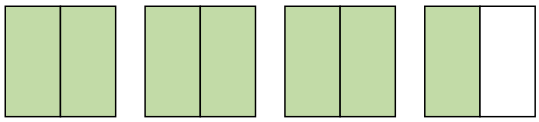

2)

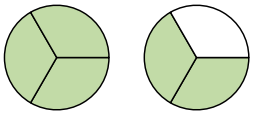

3)

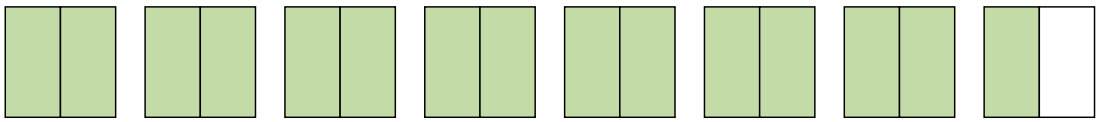

4)

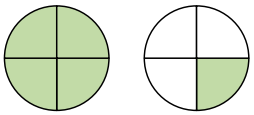

5)

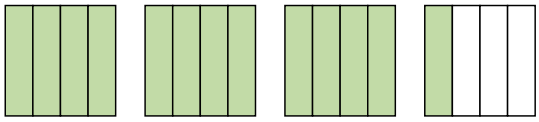

Schreibe jede Anzahl als unechten Bruch.

6)

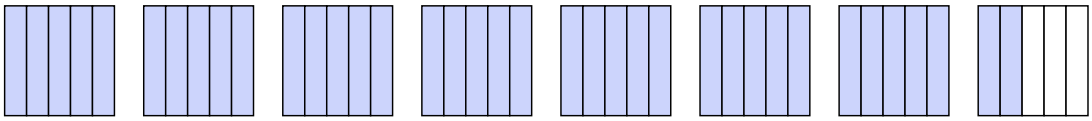

7)

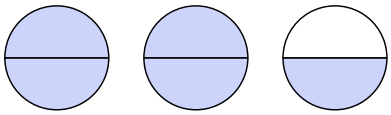

8)

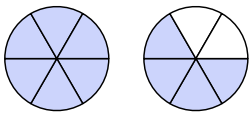

9)

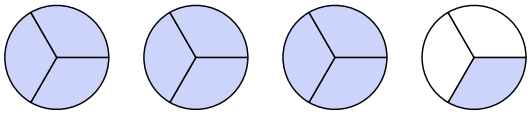

10)

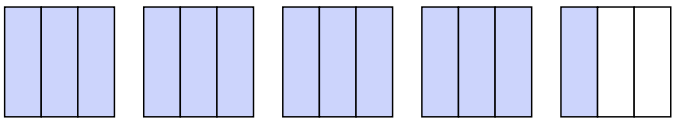

11)

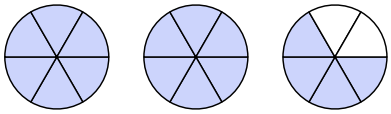

Antworten

1. $3\frac{1}{2}$
2. $1\frac{2}{3}$
3. $7\frac{1}{2}$
4. $1\frac{1}{4}$
5. $3\frac{1}{4}$
6. $\frac{37}{5}$
7. $\frac{5}{2}$
8. $\frac{10}{6}$
9. $\frac{10}{3}$
10. $\frac{13}{3}$
11. $\frac{16}{6}$

1-10	91	82	73	64	55	45	36	27	18	9
11	0									

Unechte und gemischte Brüche - visuell

Name:

Schreibe jede Anzahl als eine gemischte Zahl.

1)

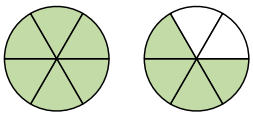

2)

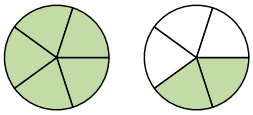

3)

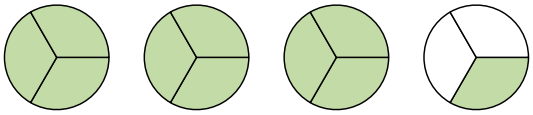

4)

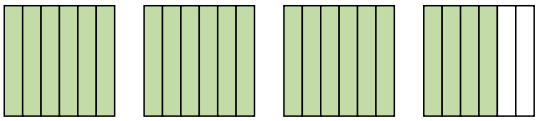

5)

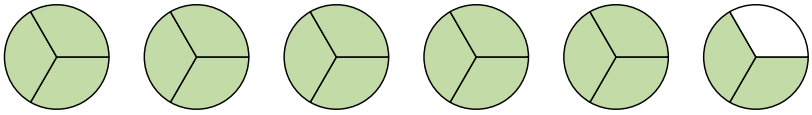

Schreibe jede Anzahl als unechten Bruch.

6)



7)

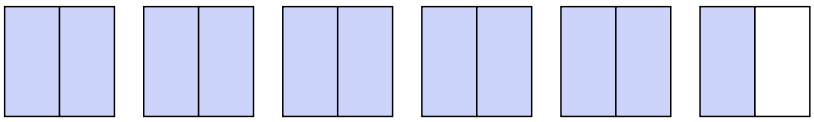

8)

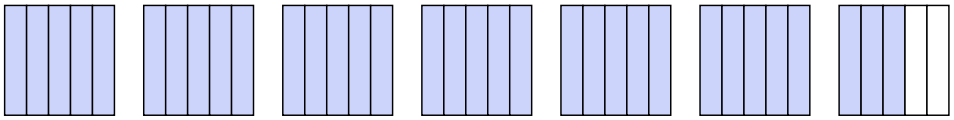

9)

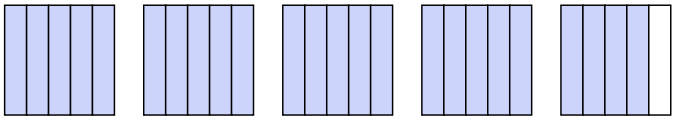

10)

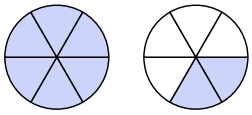

11)

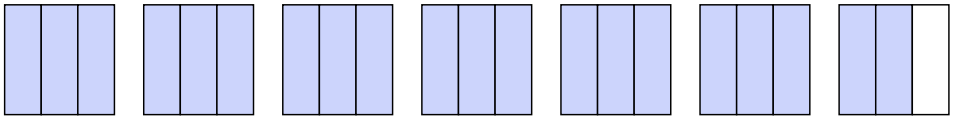

Antworten

1. _____
2. _____
3. _____
4. _____
5. _____
6. _____
7. _____
8. _____
9. _____
10. _____
11. _____

1-10	91	82	73	64	55	45	36	27	18	9
11	0									

Schreibe jede Anzahl als eine gemischte Zahl.

1) 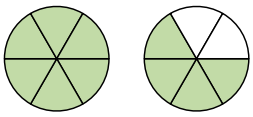

2) 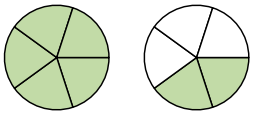

3) 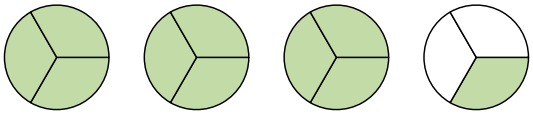

4) 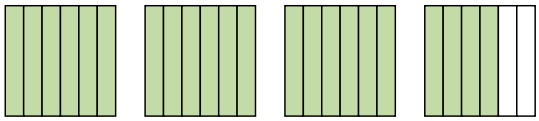

5) 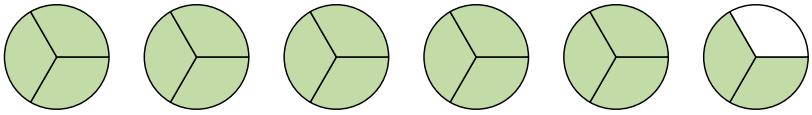

Schreibe jede Anzahl als unechten Bruch.

6) 

7) 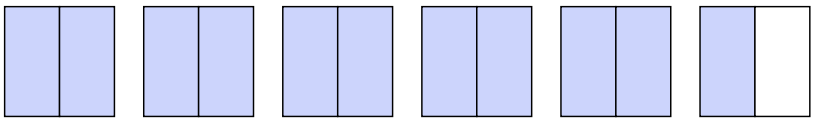

8) 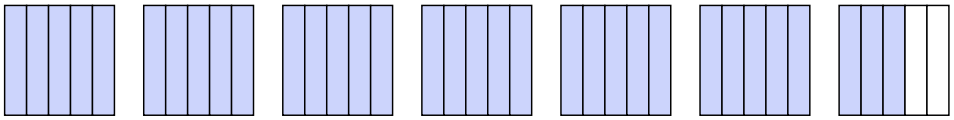

9) 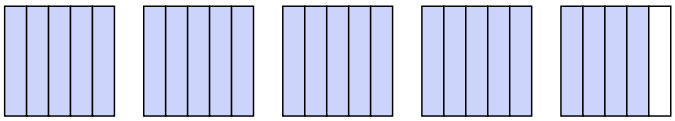

10) 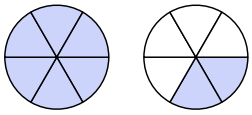

11) 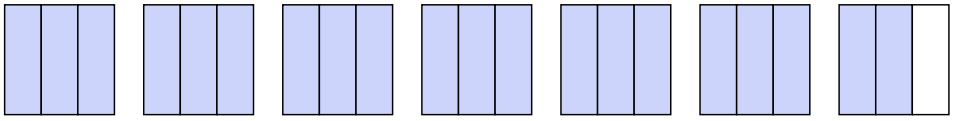

Antworten

1. $1\frac{4}{6}$
2. $1\frac{2}{5}$
3. $3\frac{1}{3}$
4. $3\frac{4}{6}$
5. $5\frac{2}{3}$
6. $\frac{5}{2}$
7. $\frac{11}{2}$
8. $\frac{33}{5}$
9. $\frac{24}{5}$
10. $\frac{8}{6}$
11. $\frac{20}{3}$

1-10	91	82	73	64	55	45	36	27	18	9
11	0									

Unechte und gemischte Brüche - visuell

Name:

Schreibe jede Anzahl als eine gemischte Zahl.

1) 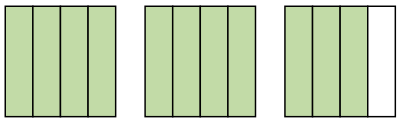

2) 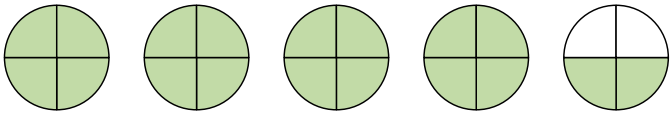

3) 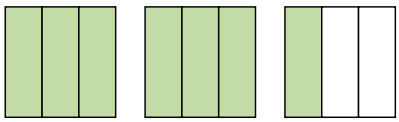

4) 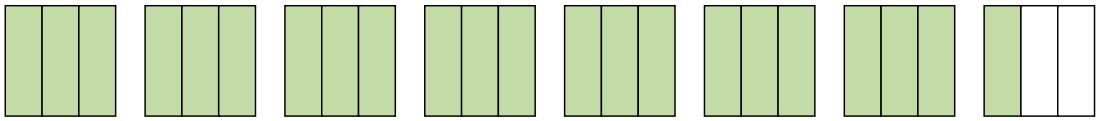

5) 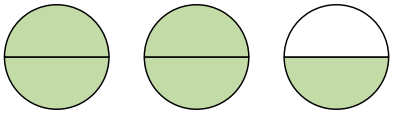

Schreibe jede Anzahl als unechten Bruch.

6) 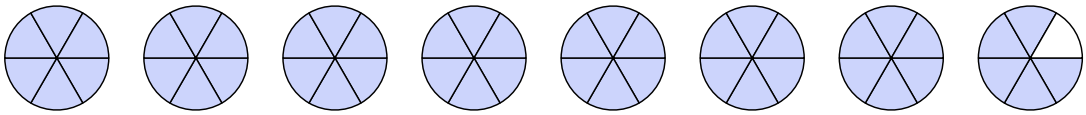

7) 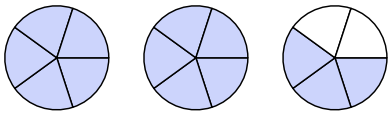

8) 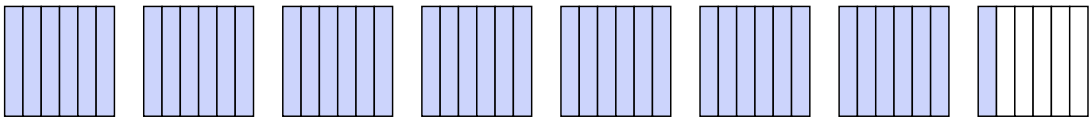

9) 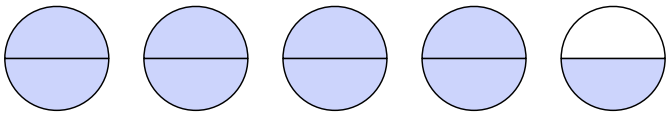

10) 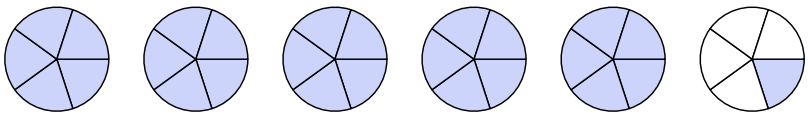

11) 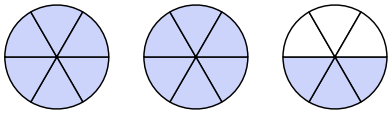

Antworten

1. _____
2. _____
3. _____
4. _____
5. _____
6. _____
7. _____
8. _____
9. _____
10. _____
11. _____

1-10	91	82	73	64	55	45	36	27	18	9
11	0									

Unechte und gemischte Brüche - visuell

Name: **Lösungsschlüssel**

Schreibe jede Anzahl als eine gemischte Zahl.

1) 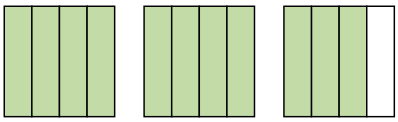

2) 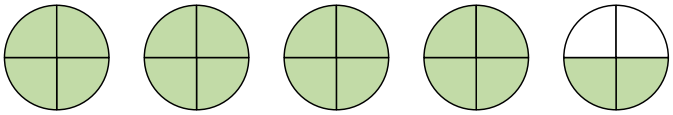

3) 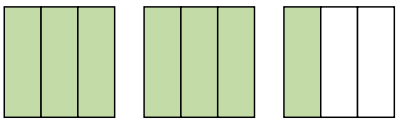

4) 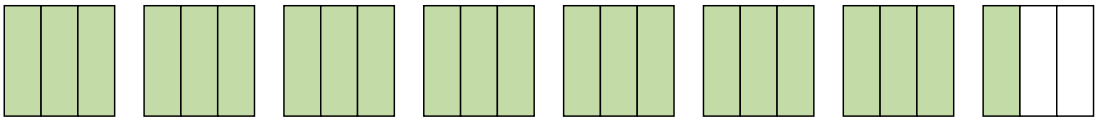

5) 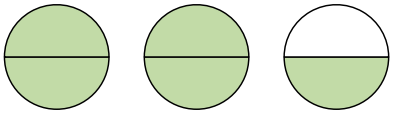

Schreibe jede Anzahl als unechten Bruch.

6) 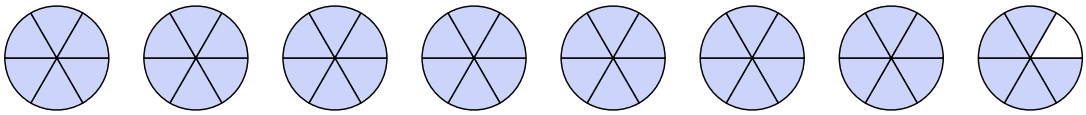

7) 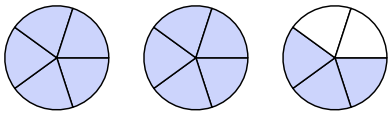

8) 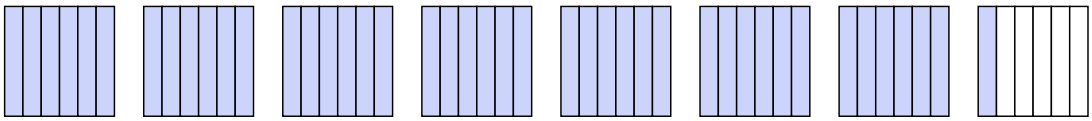

9) 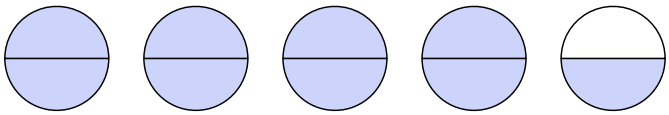

10) 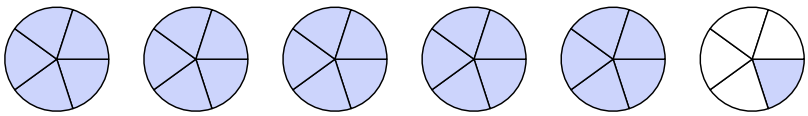

11) 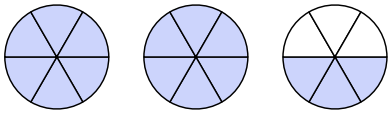

Antworten

1. $2\frac{3}{4}$
2. $4\frac{2}{4}$
3. $2\frac{1}{3}$
4. $7\frac{1}{3}$
5. $2\frac{1}{2}$
6. $\frac{47}{6}$
7. $\frac{13}{5}$
8. $\frac{43}{6}$
9. $\frac{9}{2}$
10. $\frac{26}{5}$
11. $\frac{15}{6}$

1-10	91	82	73	64	55	45	36	27	18	9
11	0									

Unechte und gemischte Brüche - visuell

Name:

Schreibe jede Anzahl als eine gemischte Zahl.

1)

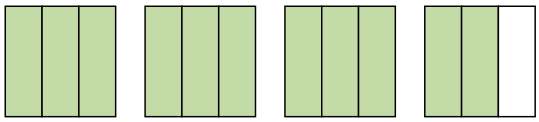

2)

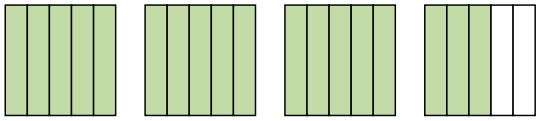

3)

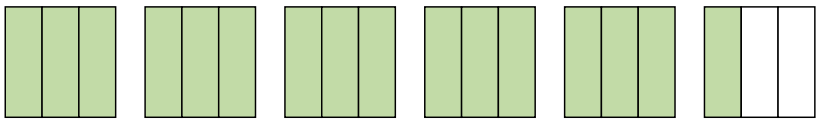

4)

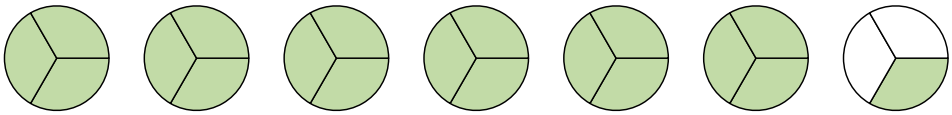

5)



Schreibe jede Anzahl als unechten Bruch.

6)

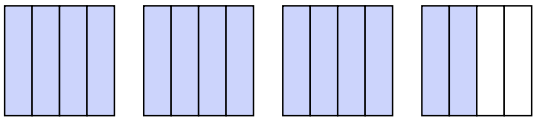

7)

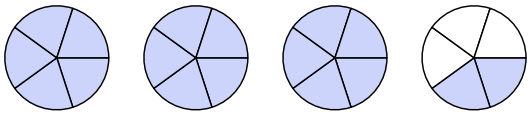

8)

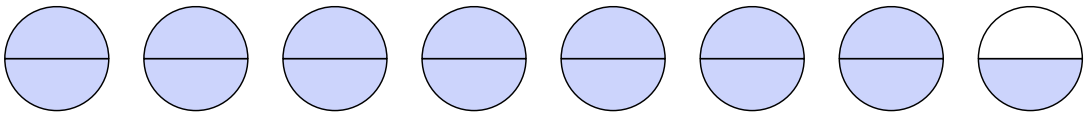

9)

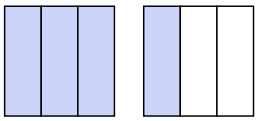

10)

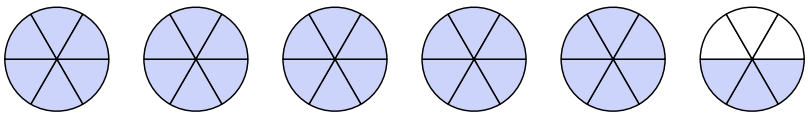

11)

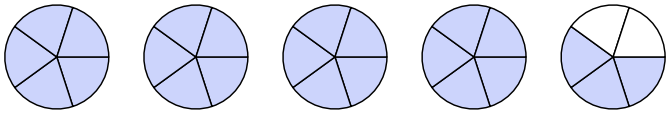

Antworten

1. _____
2. _____
3. _____
4. _____
5. _____
6. _____
7. _____
8. _____
9. _____
10. _____
11. _____

1-10	91	82	73	64	55	45	36	27	18	9
11	0									

Name: **Lösungsschlüssel**

Schreibe jede Anzahl als eine gemischte Zahl.

1) 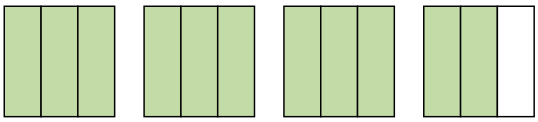

2) 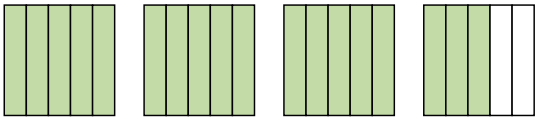

3) 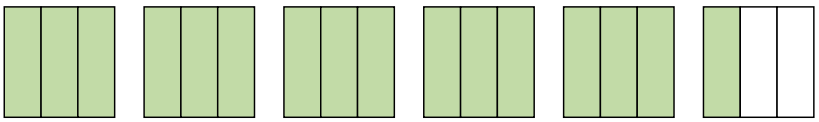

4) 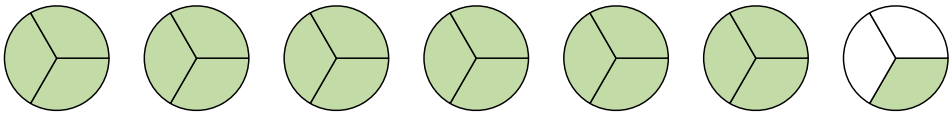

5) 

Schreibe jede Anzahl als unechten Bruch.

6) 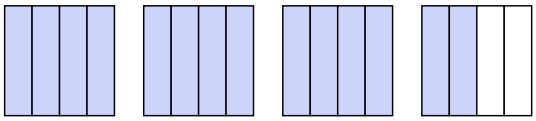

7) 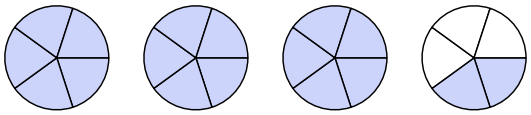

8) 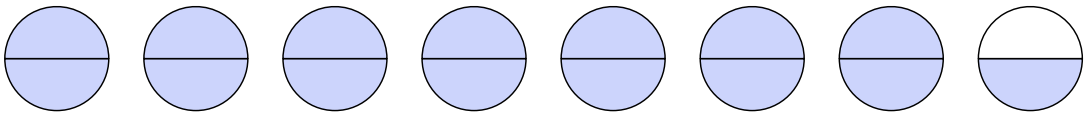

9) 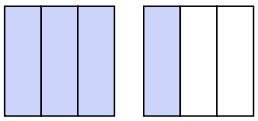

10) 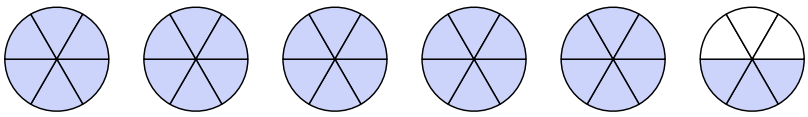

11) 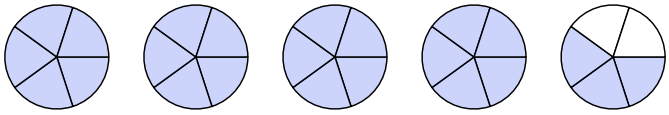

Antworten

1. $3\frac{2}{3}$
2. $3\frac{3}{5}$
3. $5\frac{1}{3}$
4. $6\frac{1}{3}$
5. $2\frac{1}{2}$
6. $\frac{14}{4}$
7. $\frac{17}{5}$
8. $\frac{15}{2}$
9. $\frac{4}{3}$
10. $\frac{33}{6}$
11. $\frac{23}{5}$

1-10	91	82	73	64	55	45	36	27	18	9
11	0									

Unechte und gemischte Brüche - visuell

Name:

Schreibe jede Anzahl als eine gemischte Zahl.

1)

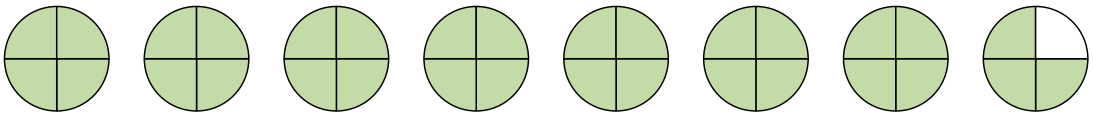

2)

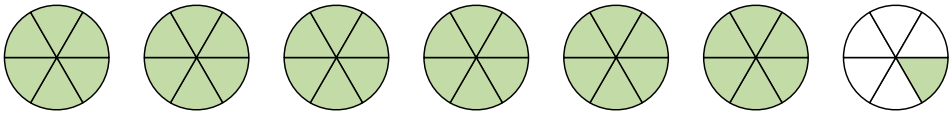

3)



4)

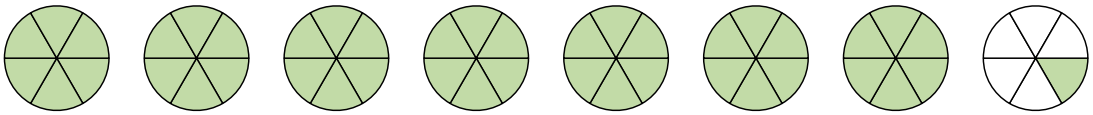

5)

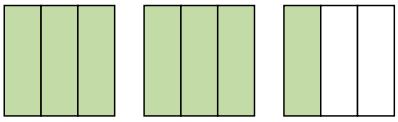

Schreibe jede Anzahl als unechten Bruch.

6)

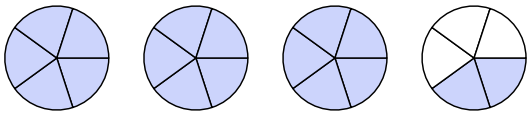

7)

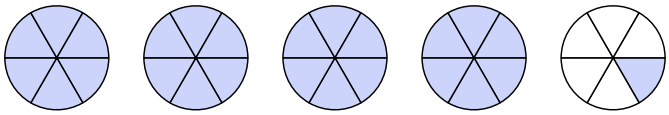

8)

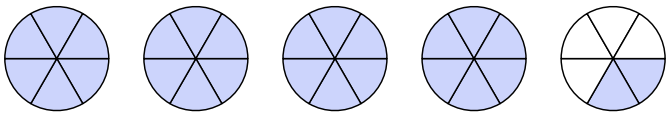

9)

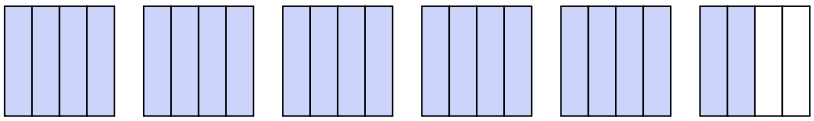

10)

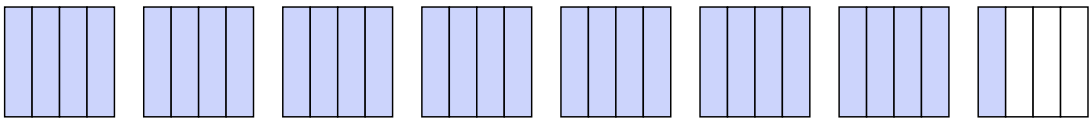

11)

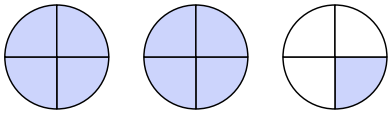

Antworten

1. _____
2. _____
3. _____
4. _____
5. _____
6. _____
7. _____
8. _____
9. _____
10. _____
11. _____

1-10	91	82	73	64	55	45	36	27	18	9
11	0									

Unechte und gemischte Brüche - visuell

Name: **Lösungsschlüssel**

Schreibe jede Anzahl als eine gemischte Zahl.

1) 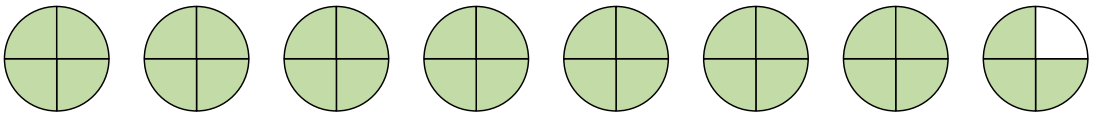

2) 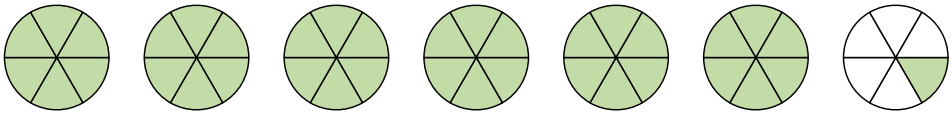

3) 

4) 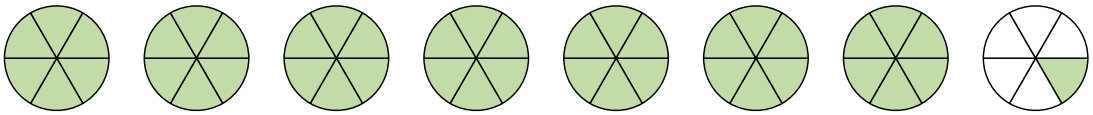

5) 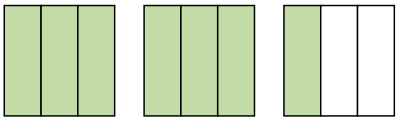

Schreibe jede Anzahl als unechten Bruch.

6) 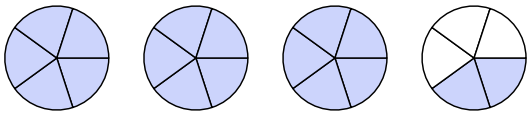

7) 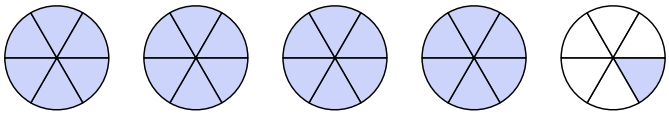

8) 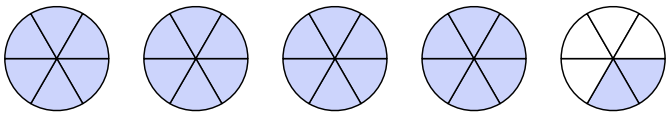

9) 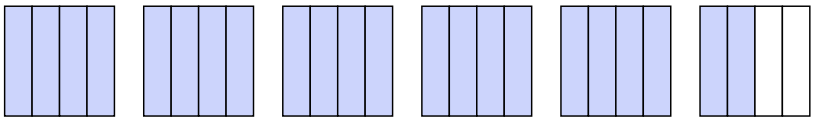

10) 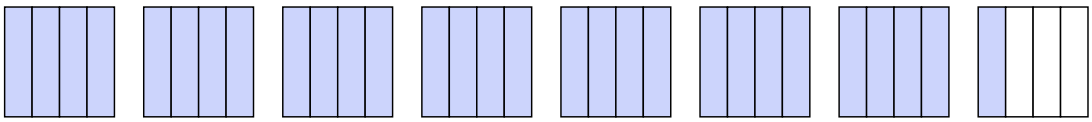

11) 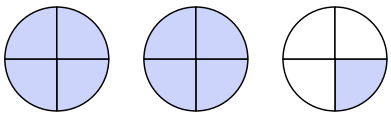

Antworten

1. $7\frac{3}{4}$
2. $6\frac{1}{6}$
3. $2\frac{5}{6}$
4. $7\frac{1}{6}$
5. $2\frac{1}{3}$
6. $\frac{17}{5}$
7. $\frac{25}{6}$
8. $\frac{26}{6}$
9. $\frac{22}{4}$
10. $\frac{29}{4}$
11. $\frac{9}{4}$

1-10	91	82	73	64	55	45	36	27	18	9
11	0									

Unechte und gemischte Brüche - visuell

Name:

Schreibe jede Anzahl als eine gemischte Zahl.

1)

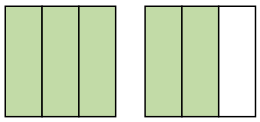

2)

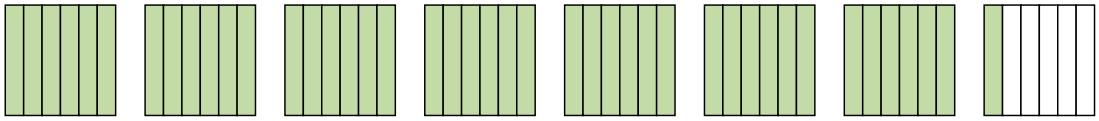

3)

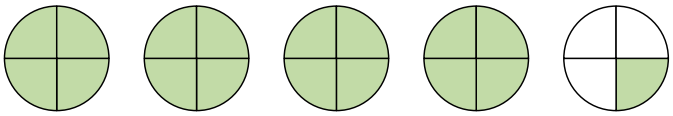

4)

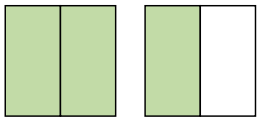

5)

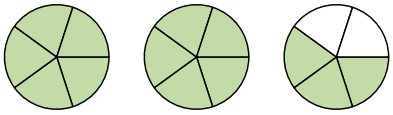

Schreibe jede Anzahl als unechten Bruch.

6)

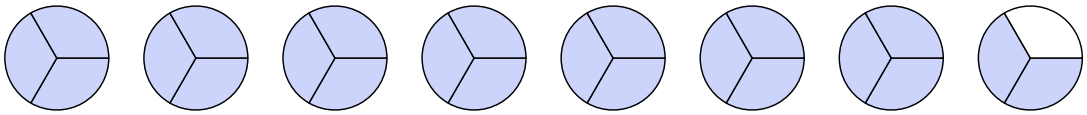

7)

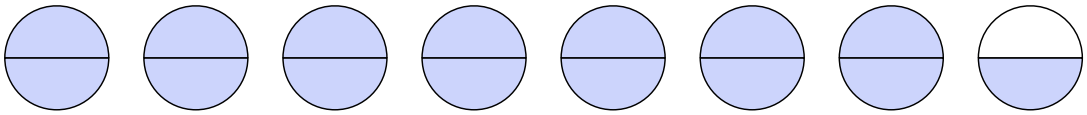

8)

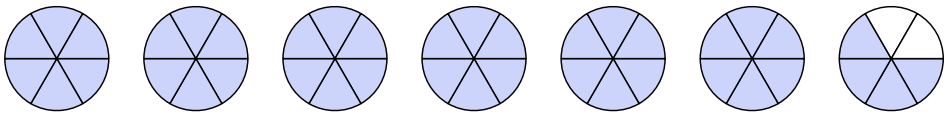

9)

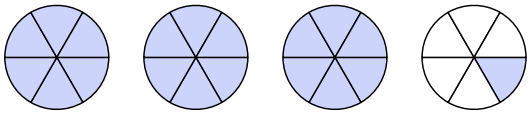

10)

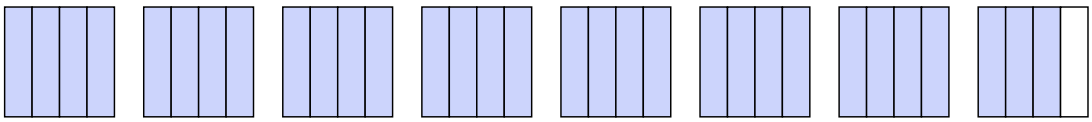

11)

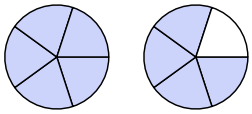

Antworten

1. _____
2. _____
3. _____
4. _____
5. _____
6. _____
7. _____
8. _____
9. _____
10. _____
11. _____

1-10	91	82	73	64	55	45	36	27	18	9
11	0									

Schreibe jede Anzahl als eine gemischte Zahl.

1) 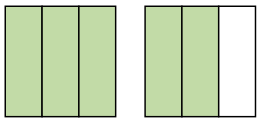

2) 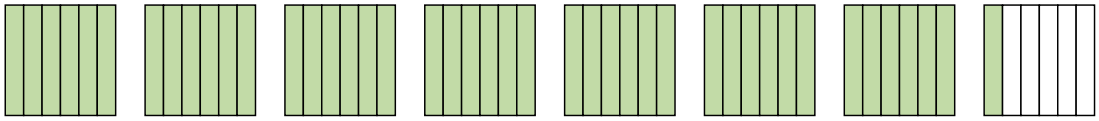

3) 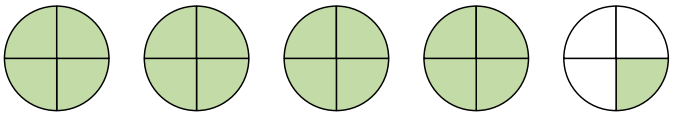

4) 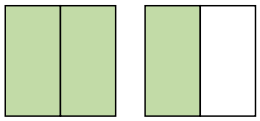

5) 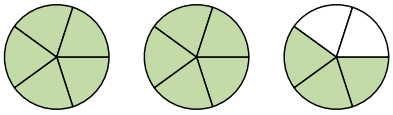

Schreibe jede Anzahl als unechten Bruch.

6) 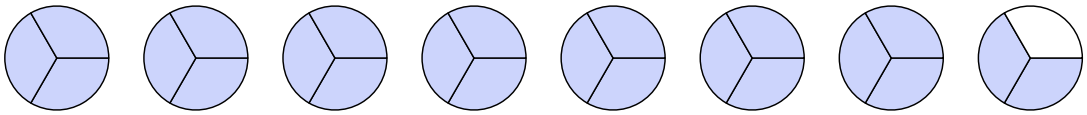

7) 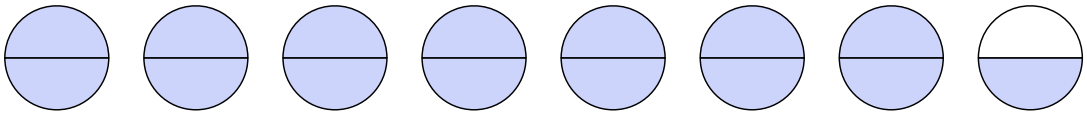

8) 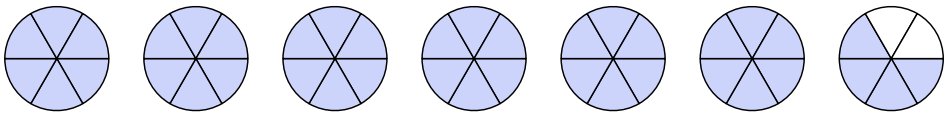

9) 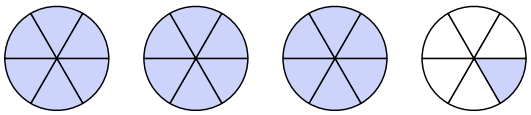

10) 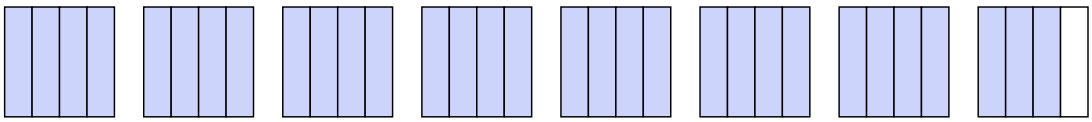

11) 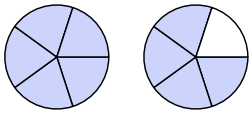

Antworten

1. $1\frac{2}{3}$
2. $7\frac{1}{6}$
3. $4\frac{1}{4}$
4. $1\frac{1}{2}$
5. $2\frac{3}{5}$
6. $\frac{23}{3}$
7. $\frac{15}{2}$
8. $\frac{40}{6}$
9. $\frac{19}{6}$
10. $\frac{31}{4}$
11. $\frac{9}{5}$

1-10	91	82	73	64	55	45	36	27	18	9
11	0									

Unechte und gemischte Brüche - visuell

Name:

Schreibe jede Anzahl als eine gemischte Zahl.

1)

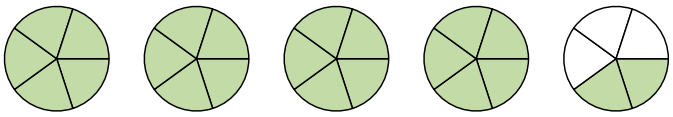

2)

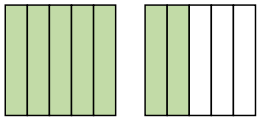

3)

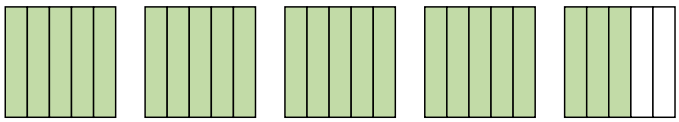

4)

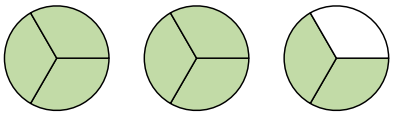

5)

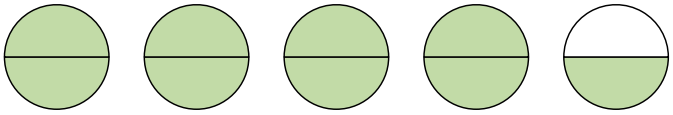

Schreibe jede Anzahl als unechten Bruch.

6)

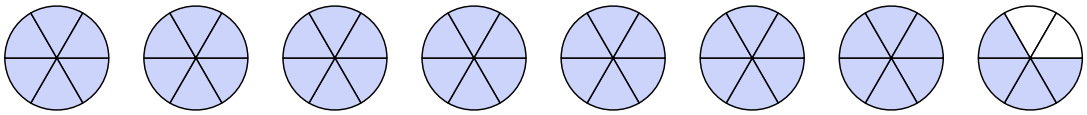

7)

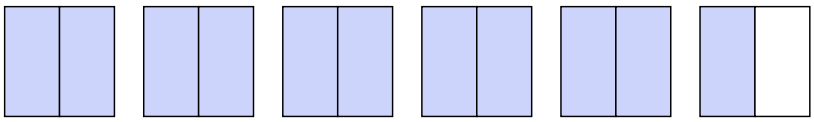

8)

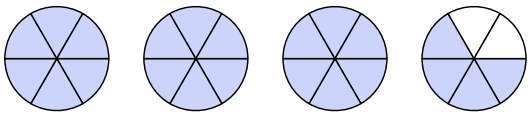

9)

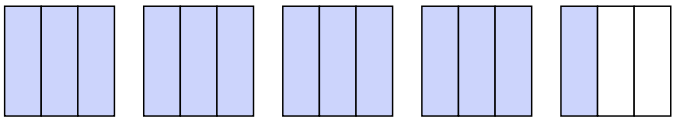

10)

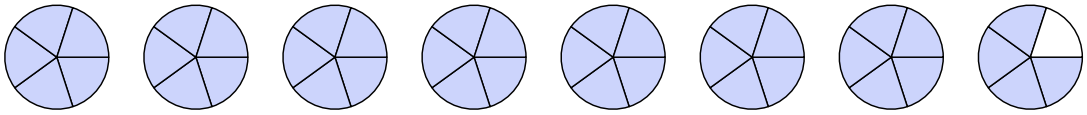

11)

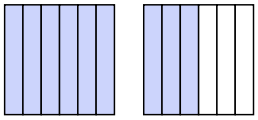

Antworten

1. _____
2. _____
3. _____
4. _____
5. _____
6. _____
7. _____
8. _____
9. _____
10. _____
11. _____

1-10	91	82	73	64	55	45	36	27	18	9
11	0									

Name: **Lösungsschlüssel**

Schreibe jede Anzahl als eine gemischte Zahl.

1) 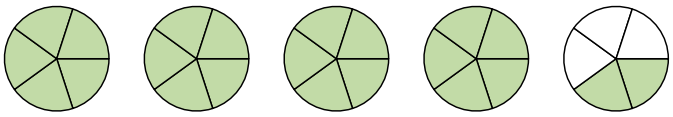

2) 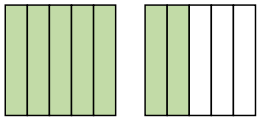

3) 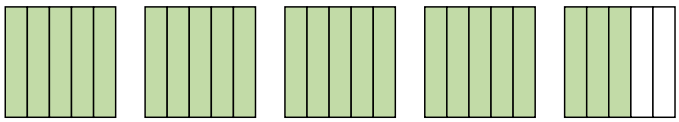

4) 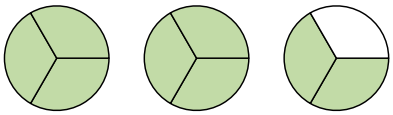

5) 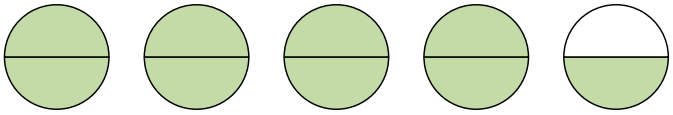

Schreibe jede Anzahl als unechten Bruch.

6) 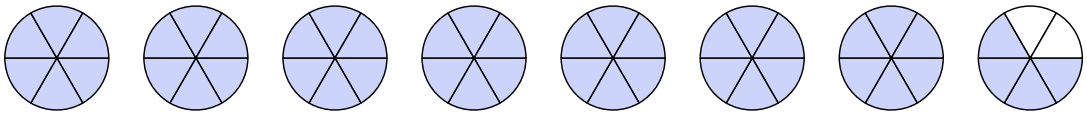

7) 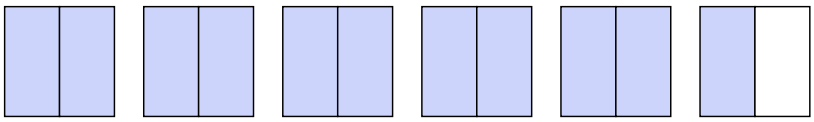

8) 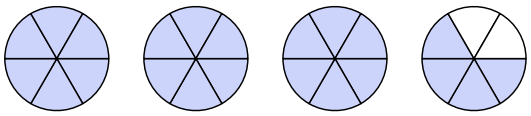

9) 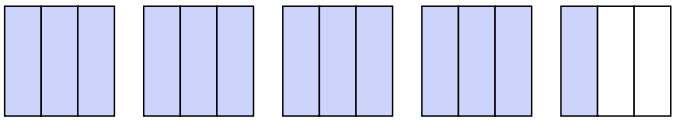

10) 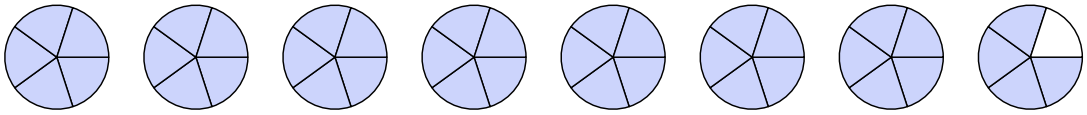

11) 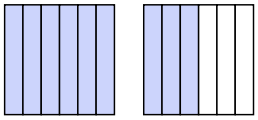

Antworten

1. $4\frac{2}{5}$
2. $1\frac{2}{5}$
3. $4\frac{3}{5}$
4. $2\frac{2}{3}$
5. $4\frac{1}{2}$
6. $\frac{46}{6}$
7. $\frac{11}{2}$
8. $\frac{22}{6}$
9. $\frac{13}{3}$
10. $\frac{39}{5}$
11. $\frac{9}{6}$

1-10	91	82	73	64	55	45	36	27	18	9
11	0									

Unechte und gemischte Brüche - visuell

Name:

Schreibe jede Anzahl als eine gemischte Zahl.

1) 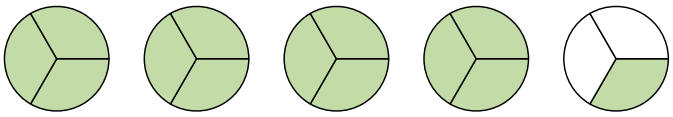

2) 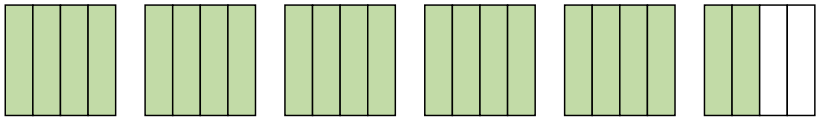

3) 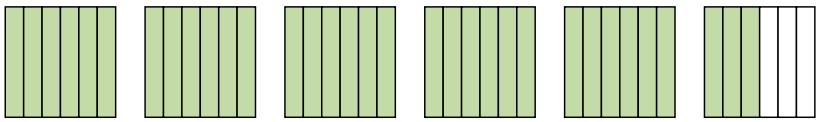

4) 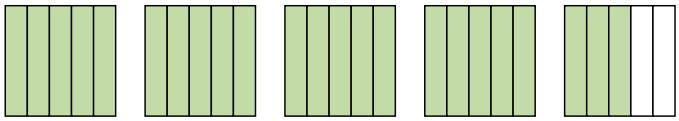

5) 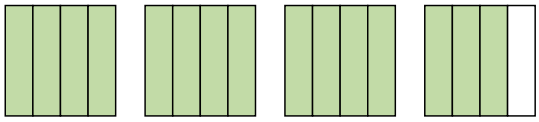

Schreibe jede Anzahl als unechten Bruch.

6) 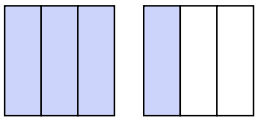

7) 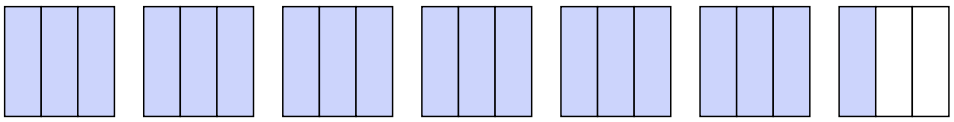

8) 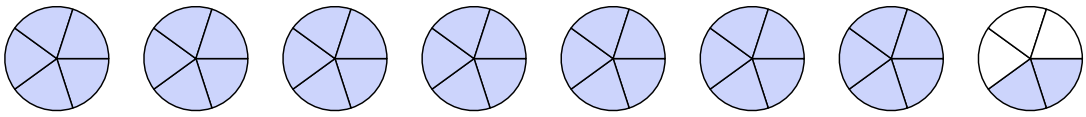

9) 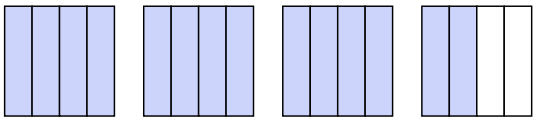

10) 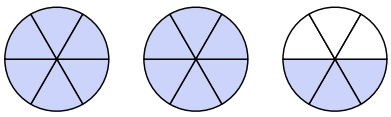

11) 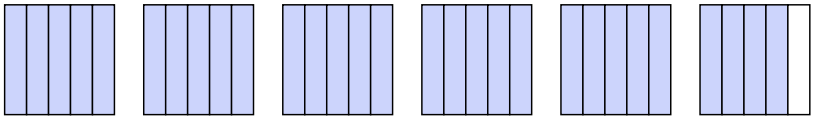

Antworten

1. _____
2. _____
3. _____
4. _____
5. _____
6. _____
7. _____
8. _____
9. _____
10. _____
11. _____

1-10	91	82	73	64	55	45	36	27	18	9
11	0									

Unechte und gemischte Brüche - visuell

Name: **Lösungsschlüssel**

Schreibe jede Anzahl als eine gemischte Zahl.

1) 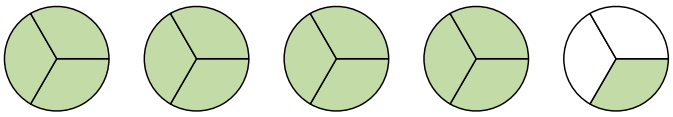

2) 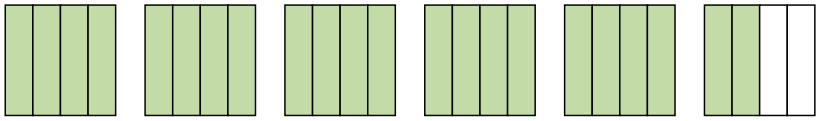

3) 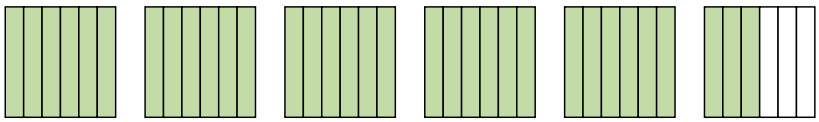

4) 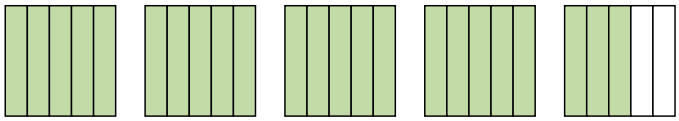

5) 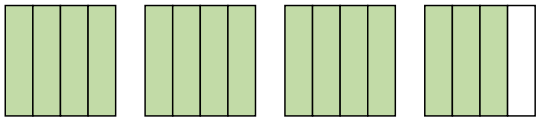

Schreibe jede Anzahl als unechten Bruch.

6) 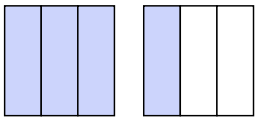

7) 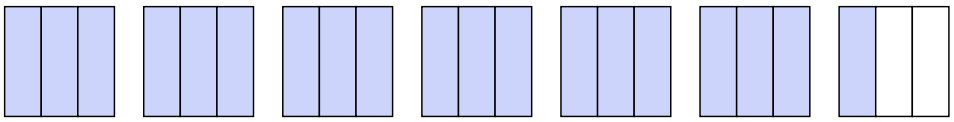

8) 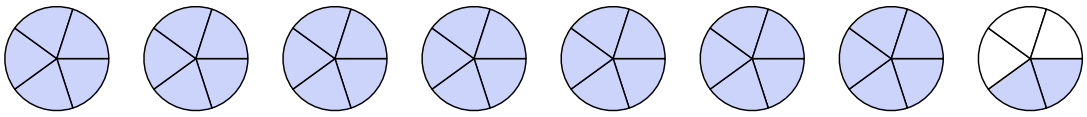

9) 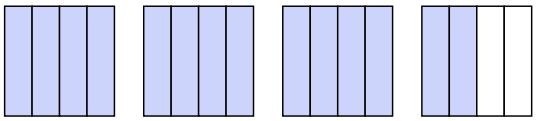

10) 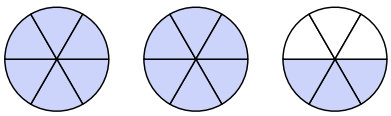

11) 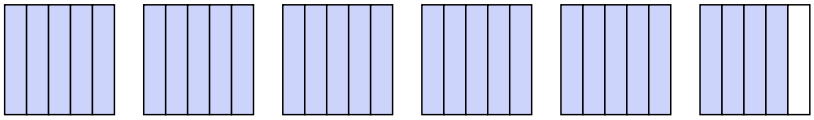

Antworten

1. $4\frac{1}{3}$
2. $5\frac{2}{4}$
3. $5\frac{3}{6}$
4. $4\frac{3}{5}$
5. $3\frac{3}{4}$
6. $\frac{4}{3}$
7. $\frac{19}{3}$
8. $\frac{37}{5}$
9. $\frac{14}{4}$
10. $\frac{15}{6}$
11. $\frac{29}{5}$

1-10	91	82	73	64	55	45	36	27	18	9
11	0									

Unechte und gemischte Brüche - visuell

Name:

Schreibe jede Anzahl als eine gemischte Zahl.

1) 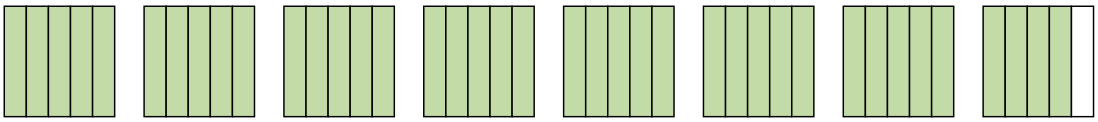

2) 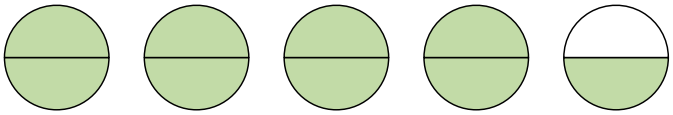

3) 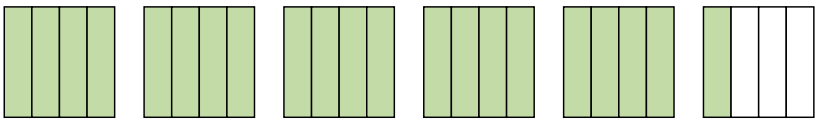

4) 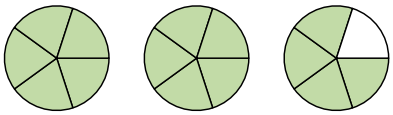

5) 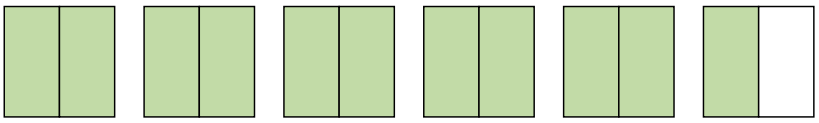

Schreibe jede Anzahl als unechten Bruch.

6) 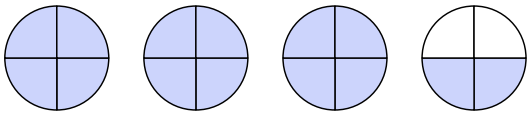

7) 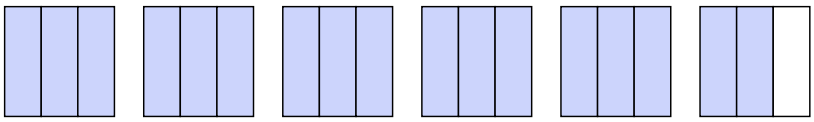

8) 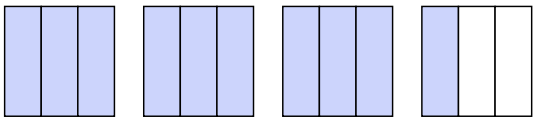

9) 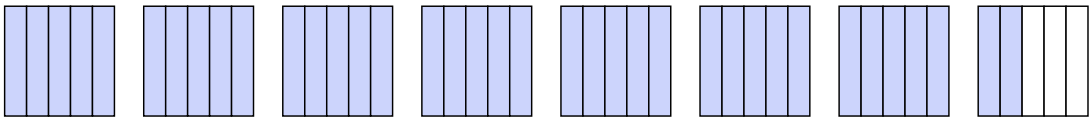

10) 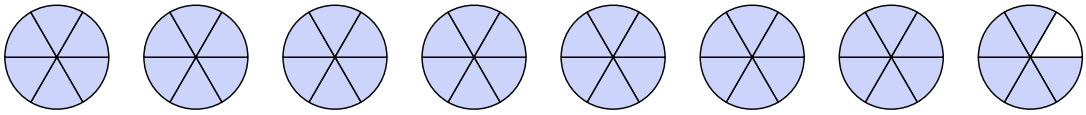

11) 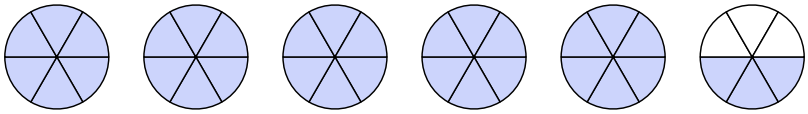

Antworten

1. _____
2. _____
3. _____
4. _____
5. _____
6. _____
7. _____
8. _____
9. _____
10. _____
11. _____

1-10	91	82	73	64	55	45	36	27	18	9
11	0									

Unechte und gemischte Brüche - visuell

Name: **Lösungsschlüssel**

Schreibe jede Anzahl als eine gemischte Zahl.

1) 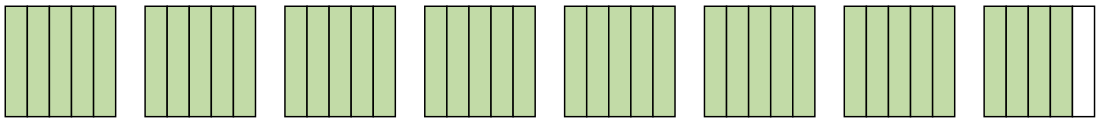

2) 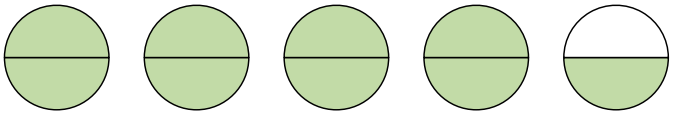

3) 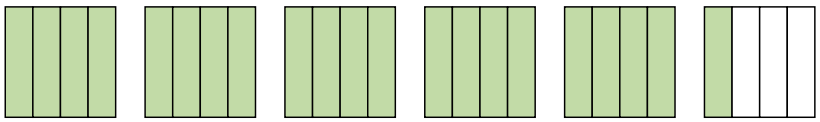

4) 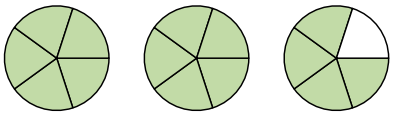

5) 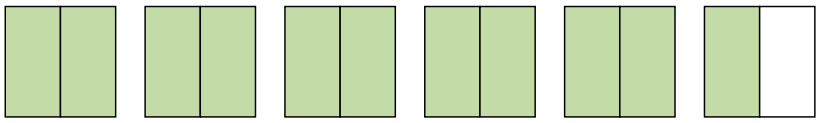

Schreibe jede Anzahl als unechten Bruch.

6) 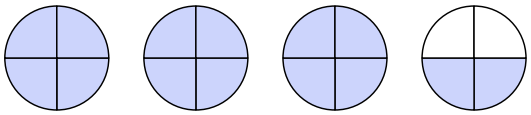

7) 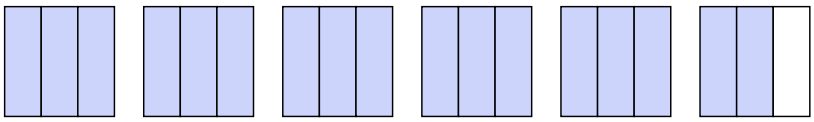

8) 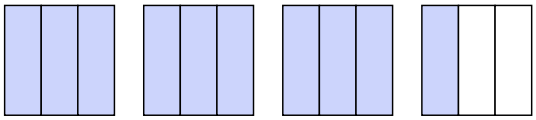

9) 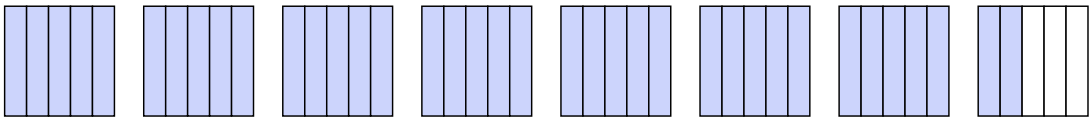

10) 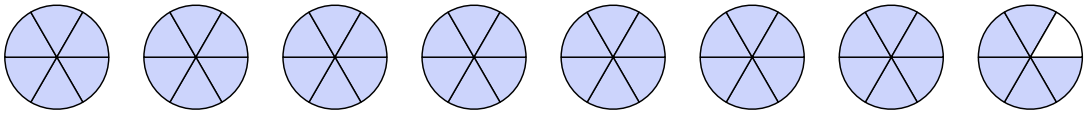

11) 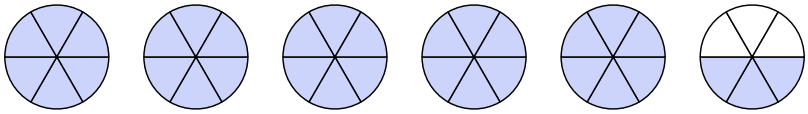

Antworten

1. $7\frac{4}{5}$
2. $4\frac{1}{2}$
3. $5\frac{1}{4}$
4. $2\frac{4}{5}$
5. $5\frac{1}{2}$
6. $\frac{14}{4}$
7. $\frac{17}{3}$
8. $\frac{10}{3}$
9. $\frac{37}{5}$
10. $\frac{47}{6}$
11. $\frac{33}{6}$

1-10	91	82	73	64	55	45	36	27	18	9
11	0									

Unechte und gemischte Brüche - visuell

Name:

Schreibe jede Anzahl als eine gemischte Zahl.

1)

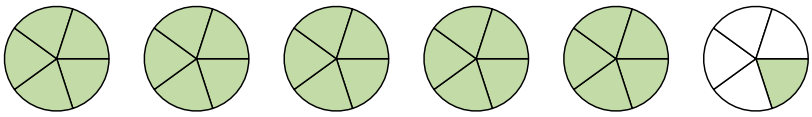

2)

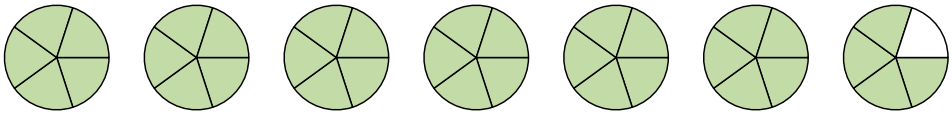

3)

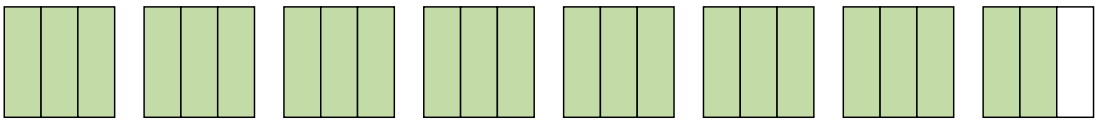

4)

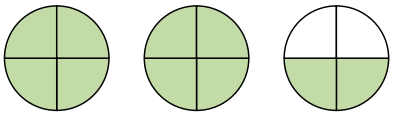

5)



Schreibe jede Anzahl als unechten Bruch.

6)

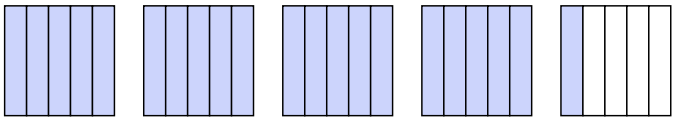

7)

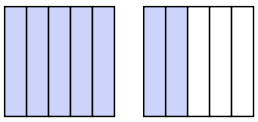

8)

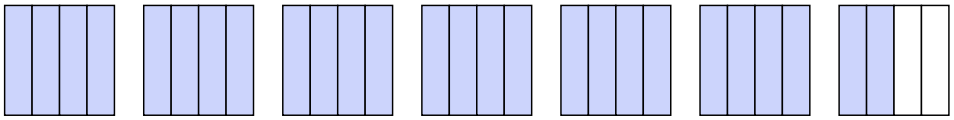

9)

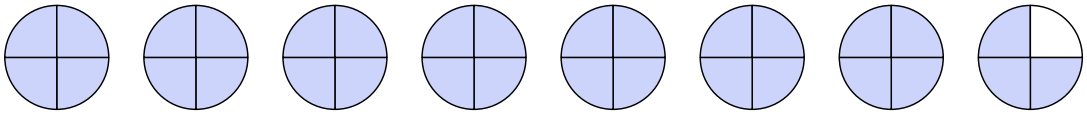

10)

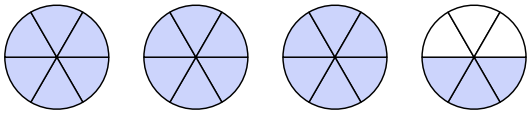

11)

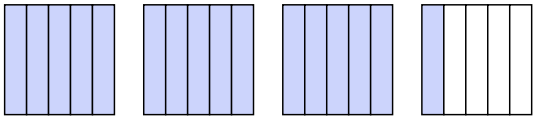

Antworten

1. _____
2. _____
3. _____
4. _____
5. _____
6. _____
7. _____
8. _____
9. _____
10. _____
11. _____

1-10	91	82	73	64	55	45	36	27	18	9
11	0									

Unechte und gemischte Brüche - visuell

Name: **Lösungsschlüssel**

Schreibe jede Anzahl als eine gemischte Zahl.

1) 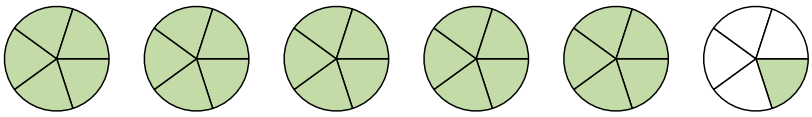

2) 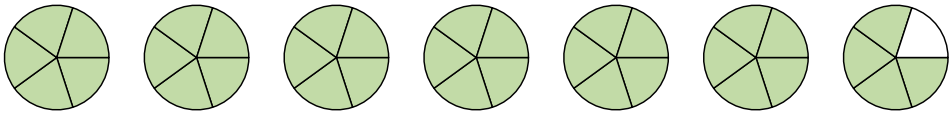

3) 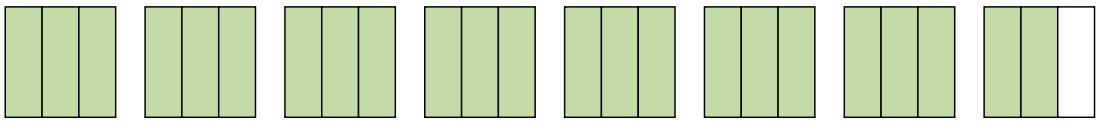

4) 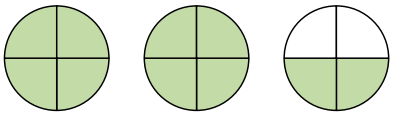

5) 

Schreibe jede Anzahl als unechten Bruch.

6) 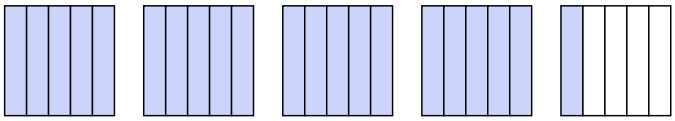

7) 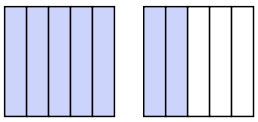

8) 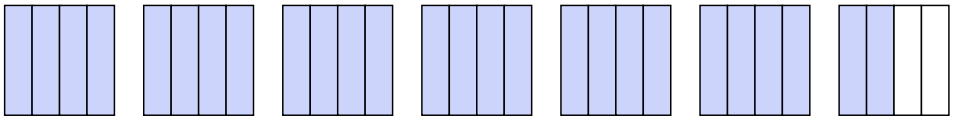

9) 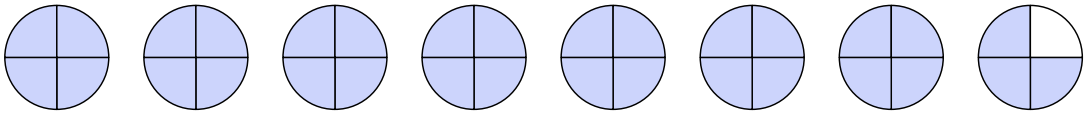

10) 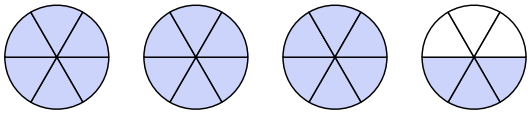

11) 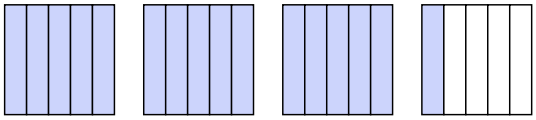

Antworten

1. $5\frac{1}{5}$
2. $6\frac{4}{5}$
3. $7\frac{2}{3}$
4. $2\frac{2}{4}$
5. $2\frac{1}{2}$
6. $\frac{21}{5}$
7. $\frac{7}{5}$
8. $\frac{26}{4}$
9. $\frac{31}{4}$
10. $\frac{21}{6}$
11. $\frac{16}{5}$

1-10	91	82	73	64	55	45	36	27	18	9
11	0									