Unechte und gemischte Brüche - visuell

Name:

Schreibe jede Anzahl als eine gemischte Zahl.

1) 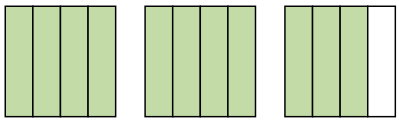

2) 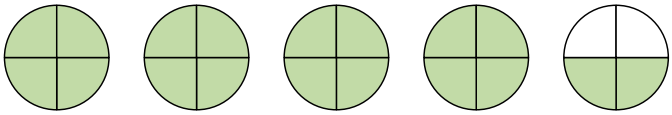

3) 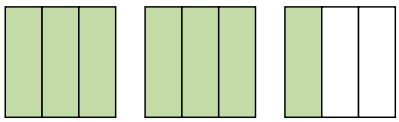

4) 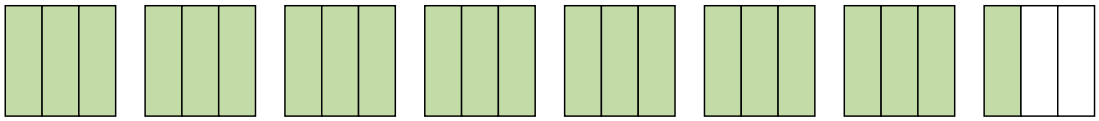

5) 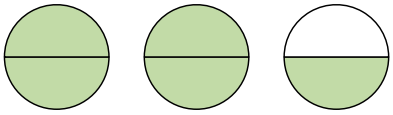

Schreibe jede Anzahl als unechten Bruch.

6) 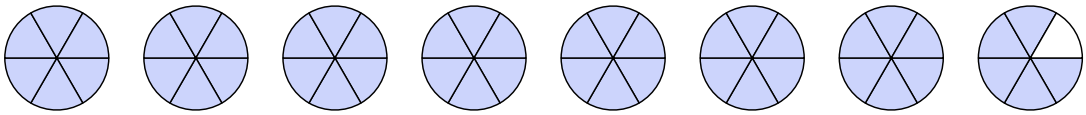

7) 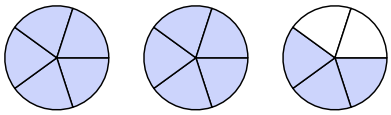

8) 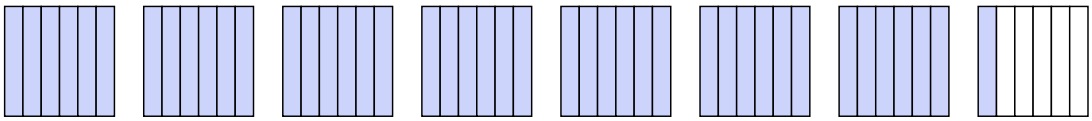

9) 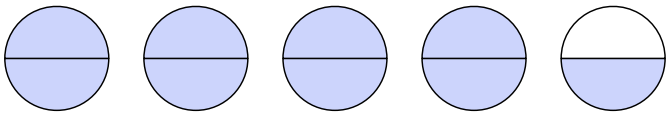

10) 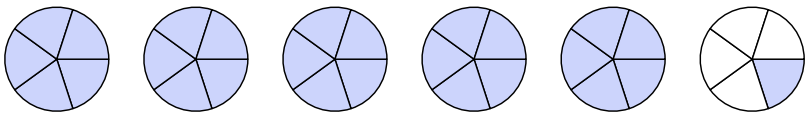

11) 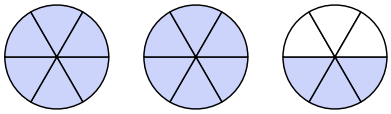

Antworten

1. _____
2. _____
3. _____
4. _____
5. _____
6. _____
7. _____
8. _____
9. _____
10. _____
11. _____

1-10	91	82	73	64	55	45	36	27	18	9
11	0									

Unechte und gemischte Brüche - visuell

Name: **Lösungsschlüssel**

Schreibe jede Anzahl als eine gemischte Zahl.

1) 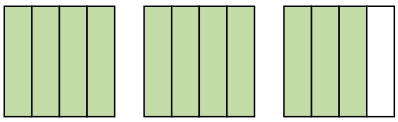

2) 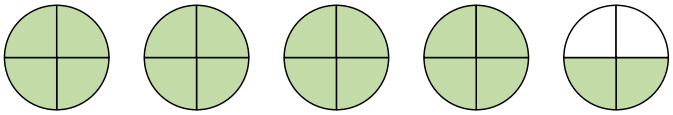

3) 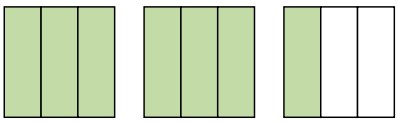

4) 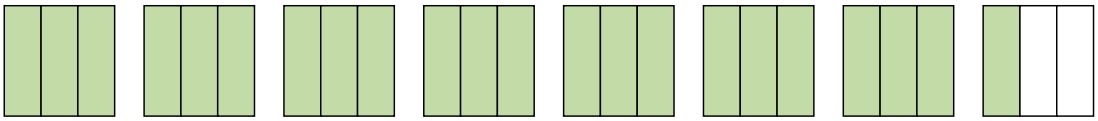

5) 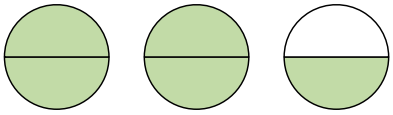

Schreibe jede Anzahl als unechten Bruch.

6) 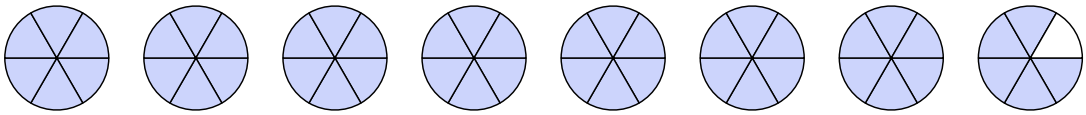

7) 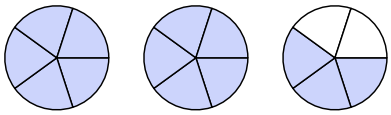

8) 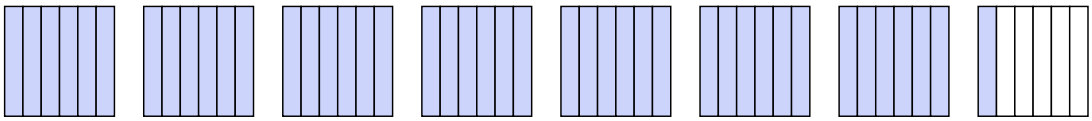

9) 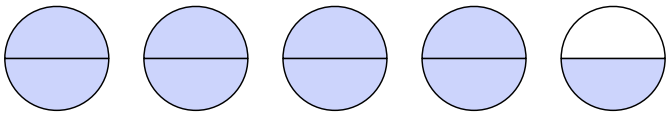

10) 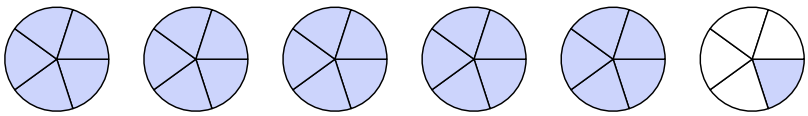

11) 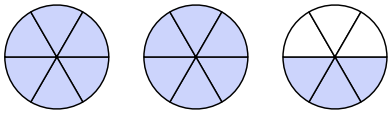

Antworten

1. $2\frac{3}{4}$
2. $4\frac{2}{4}$
3. $2\frac{1}{3}$
4. $7\frac{1}{3}$
5. $2\frac{1}{2}$
6. $\frac{47}{6}$
7. $\frac{13}{5}$
8. $\frac{43}{6}$
9. $\frac{9}{2}$
10. $\frac{26}{5}$
11. $\frac{15}{6}$

1-10	91	82	73	64	55	45	36	27	18	9
11	0									