Löse jede Aufgabe.

Antworten

1. _____
2. _____
3. _____
4. _____
5. _____
6. _____

1) Which choice represents the un-shaded portion of the number wheel?

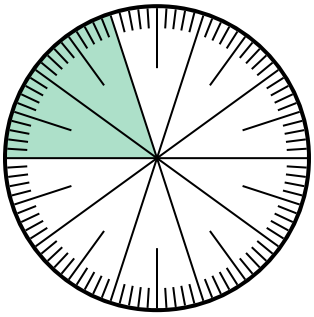

A. $^{0.8}/_{100}$ B. 0,8

C. 8 D. $^{80}/_{20}$

2) Which choice represents the un-shaded portion of the number wheel?

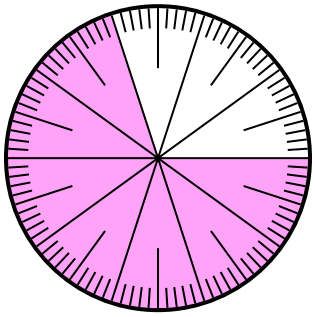

A. 0,30 B. 70

C. 0,070 D. $^{70}/_{30}$

3) Which choice represents the un-shaded portion of the number wheel?

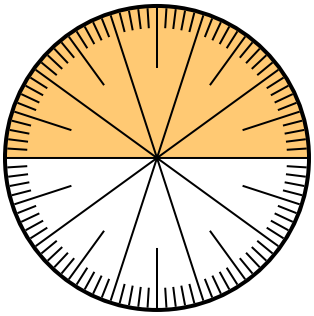

A. 5,00 B. $^{5}/_{100}$

C. $^{5}/_{100}$ D. 0,5

4) Welche Auswahl steht für den schattierten Teil des Zahlenrads?

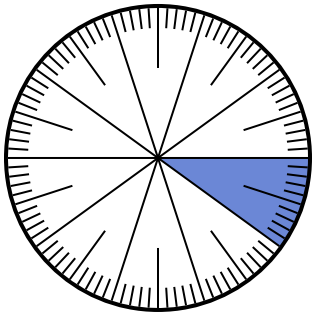

A. 0,10 B. 1

C. $^{1}/_{100}$ D. $^{0.9}/_{100}$

5) Which choice represents the un-shaded portion of the number wheel?

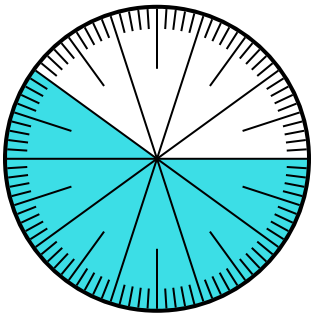

A. 4,00 B. 0,40

C. $^{40}/_{60}$ D. $^{4,00}/_{100}$

6) Welche Auswahl steht für den schattierten Teil des Zahlenrads?

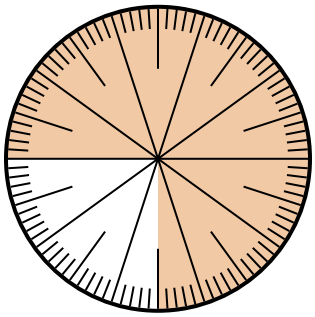

A. $^{75}/_{25}$ B. 0,075

C. $^{75}/_{100}$ D. 7,50

1-6	83	67	50	33	17	0

Löse jede Aufgabe.

1) Which choice represents the un-shaded portion of the number wheel?

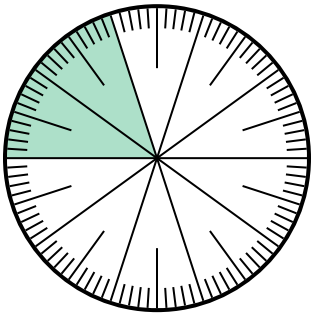

A. $^{0.8}/_{100}$ B. 0,8

C. 8 D. $^{80}/_{20}$

2) Which choice represents the un-shaded portion of the number wheel?

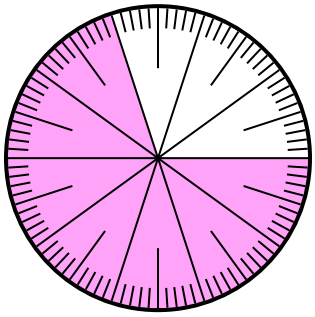

A. 0,30 B. 70

C. 0,070 D. $^{70}/_{30}$

3) Which choice represents the un-shaded portion of the number wheel?

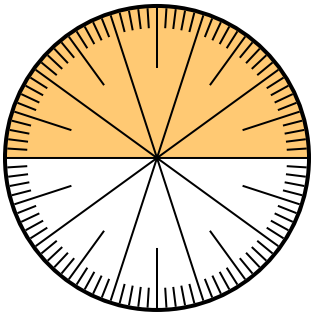

A. 5,00 B. $^{5}/_{100}$

C. $^{5}/_{100}$ D. 0,5

4) Welche Auswahl steht für den schattierten Teil des Zahlenrads?

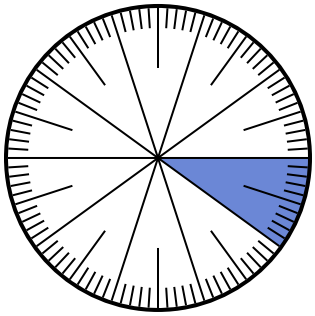

A. 0,10 B. 1

C. $^{1}/_{100}$ D. $^{0.9}/_{100}$

5) Which choice represents the un-shaded portion of the number wheel?

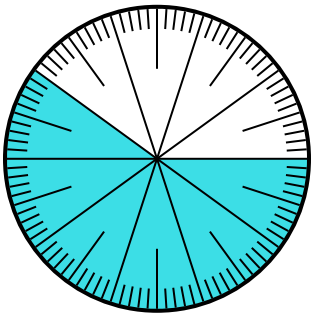

A. 4,00 B. 0,40

C. $^{40}/_{60}$ D. $^{4,00}/_{100}$

6) Welche Auswahl steht für den schattierten Teil des Zahlenrads?

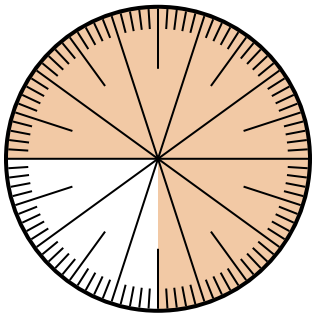

A. $^{75}/_{25}$ B. 0,075

C. $^{75}/_{100}$ D. 7,50

Antworten

1. **B**
2. **A**
3. **D**
4. **A**
5. **B**
6. **C**

1-6	83	67	50	33	17	0