Teilen durch Brüche mit dem Zahlenstrahl

Name:

Benutze den Zahlenstrahl um die Aufgabe zu lösen.

1) $2 : \frac{4}{6}$

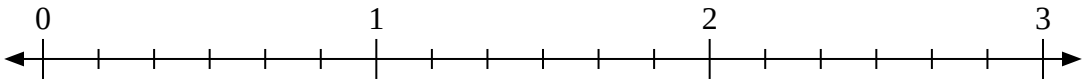

2) $4 : \frac{8}{9}$

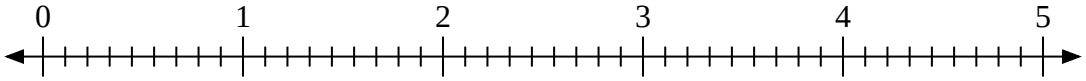

3) $4 : \frac{3}{4}$

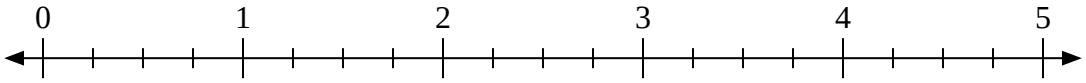

4) $3 : \frac{5}{7}$

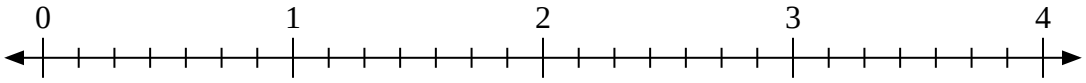

5) $3 : \frac{6}{8}$

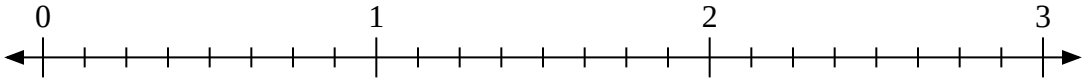

6) $3 : \frac{3}{7}$

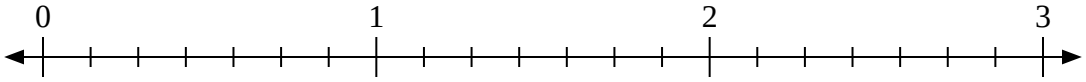

7) $5 : \frac{2}{6}$

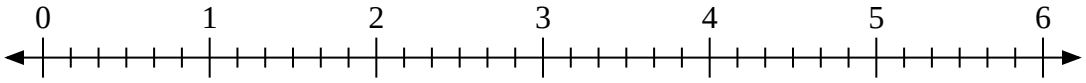

8) $6 : \frac{2}{4}$

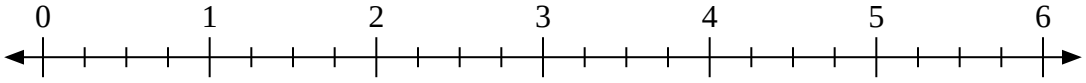

9) $2 : \frac{1}{4}$

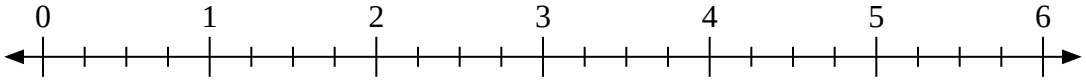

Antworten

1. _____
2. _____
3. _____
4. _____
5. _____
6. _____
7. _____
8. _____
9. _____

1-9	89	78	67	56	44	33	22	11	0

Teilen durch Brüche mit dem Zahlenstrahl Name: **Lösungsschlüssel**

Benutze den Zahlenstrahl um die Aufgabe zu lösen.

1) $2 : \frac{4}{6}$

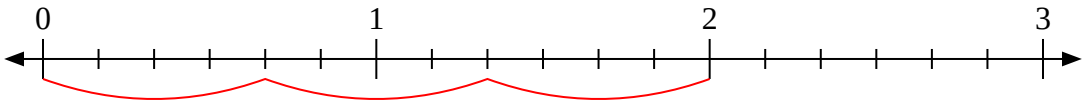

2) $4 : \frac{8}{9}$

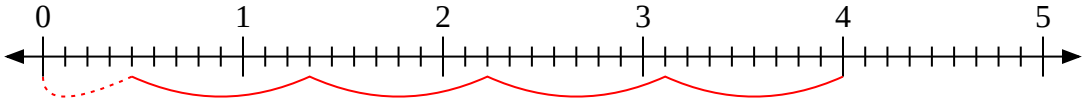

3) $4 : \frac{3}{4}$

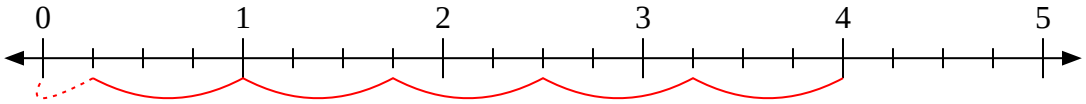

4) $3 : \frac{5}{7}$

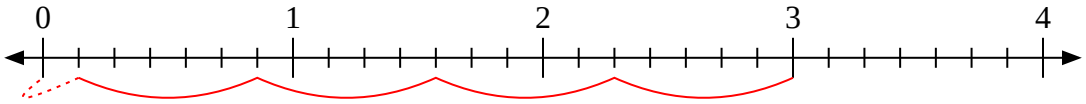

5) $3 : \frac{6}{8}$

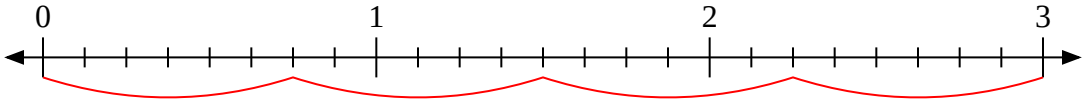

6) $3 : \frac{3}{7}$

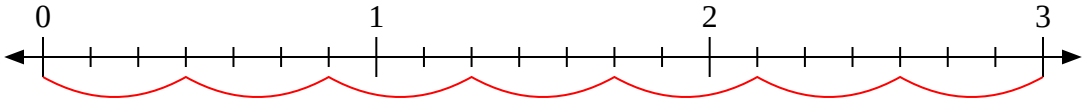

7) $5 : \frac{2}{6}$

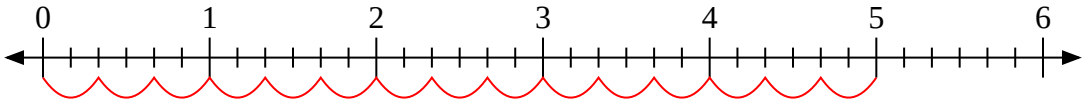

8) $6 : \frac{2}{4}$

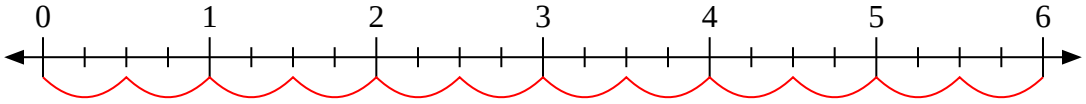

9) $2 : \frac{1}{4}$

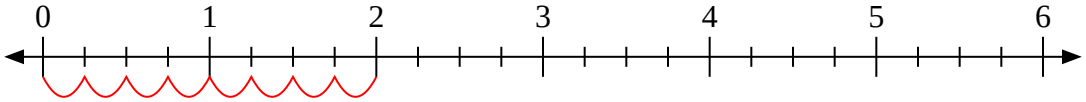

Antworten

1. **3**
2. **$4\frac{4}{8}$**
3. **$5\frac{1}{3}$**
4. **$4\frac{1}{5}$**
5. **4**
6. **7**
7. **15**
8. **12**
9. **8**

1-9	89	78	67	56	44	33	22	11	0