Division mit einem Zahlenstrahl

Name:

Benutze den Zahlenstrahl zur Lösung jeder Aufgabe.

1) 18:9=

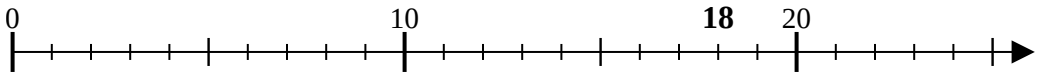

2) 15:5=

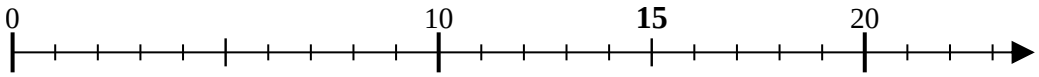

3) 8:2=

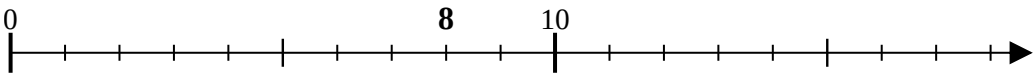

4) 16:4=

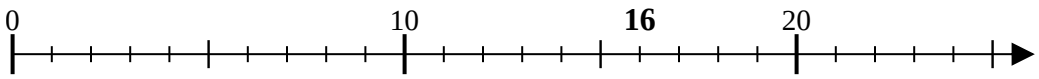

5) 40:10=

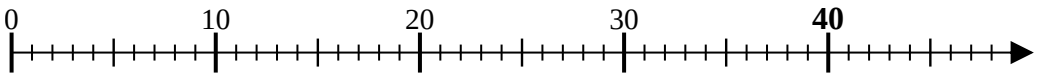

6) 4:2=

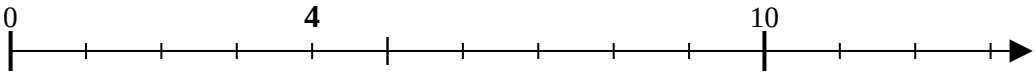

7) 45:9=

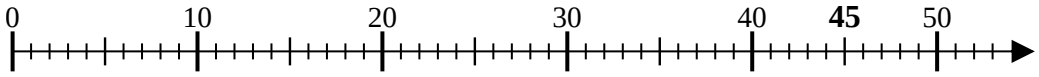

8) 15:3=

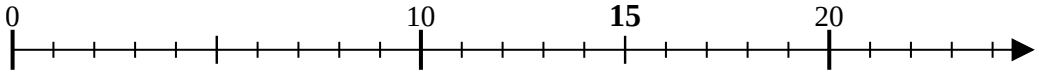

9) 28:7=

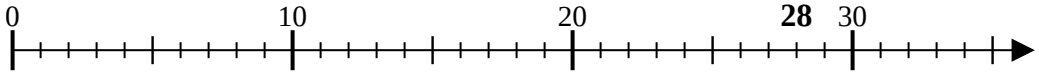

10) 16:8=

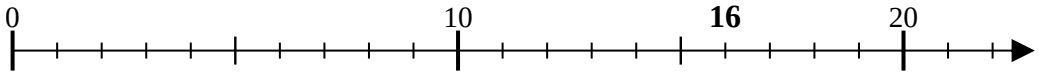

11) 8:4=

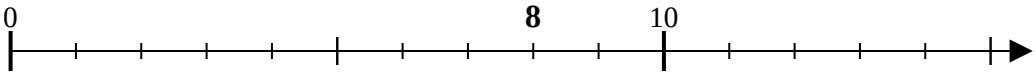

Antworten

1. _____
2. _____
3. _____
4. _____
5. _____
6. _____
7. _____
8. _____
9. _____
10. _____
11. _____

1-10	91	82	73	64	55	45	36	27	18	9
11	0									

Division mit einem Zahlenstrahl

Name: **Lösungsschlüssel**

Benutze den Zahlenstrahl zur Lösung jeder Aufgabe.

1) 18:9=

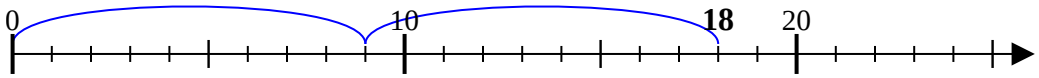

2) 15:5=

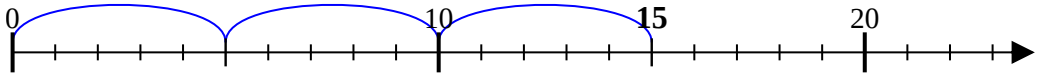

3) 8:2=

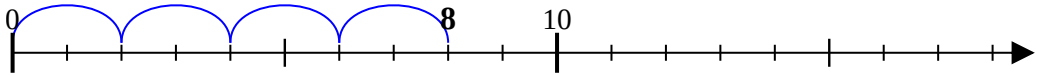

4) 16:4=

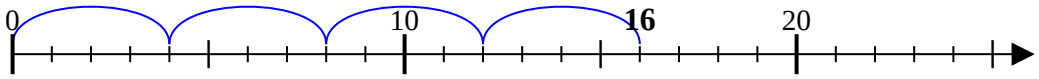

5) 40:10=

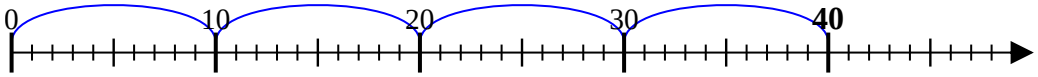

6) 4:2=

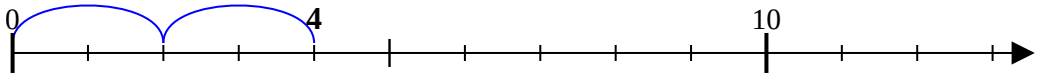

7) 45:9=

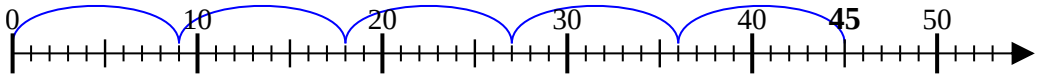

8) 15:3=

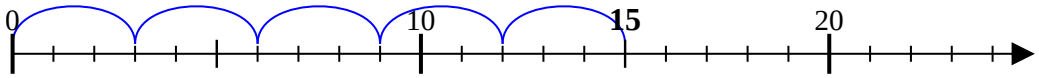

9) 28:7=

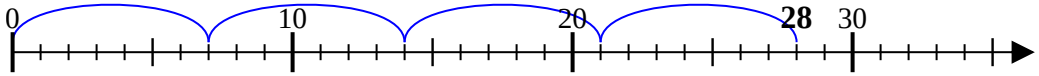

10) 16:8=

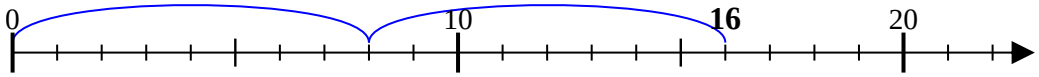

11) 8:4=

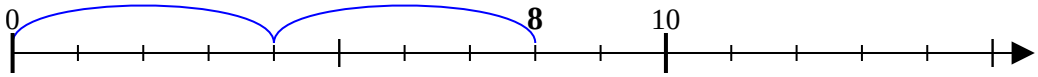

Antworten

1. 2
2. 3
3. 4
4. 4
5. 4
6. 2
7. 5
8. 5
9. 4
10. 2
11. 2

1-10	91	82	73	64	55	45	36	27	18	9
11	0									