Formen zählen

Name:

Zählen Sie die Anzahl der gezeigten Formen.

1)



2)

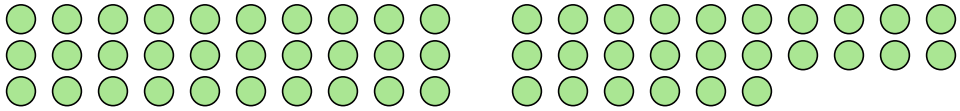

3)

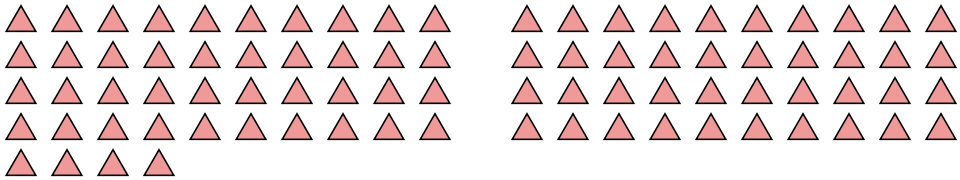

4)

5)

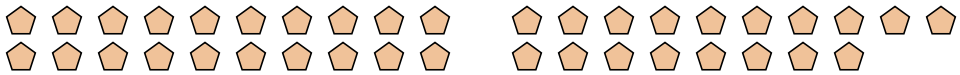

Antworten

1. _____

2. _____

3. _____

4. _____

5. _____

1-5	80	60	40	20	0

Formen zählen

Name: **Lösungsschlüssel**

Zählen Sie die Anzahl der gezeigten Formen.

1)



2)

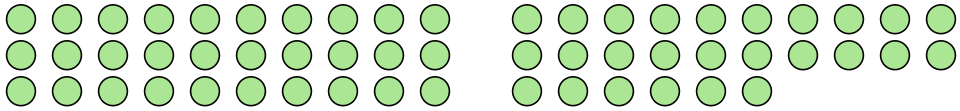

3)

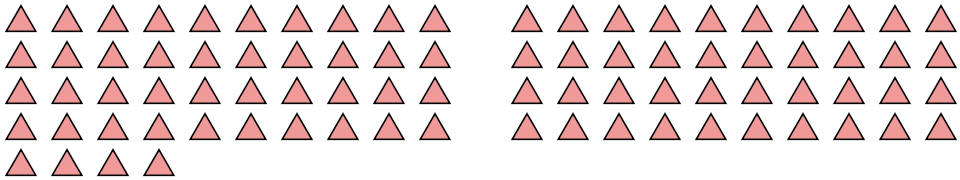

4)

5)

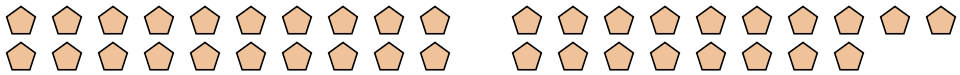

Antworten

1. **73**
2. **56**
3. **84**
4. **103**
5. **38**

1-5	80	60	40	20	0