# Zählen von Zehnergruppen

Name:

**Bestimme die Anzahl der Zehnergruppe. Dann ermittle die ganze Anzahl der kleinen Blocks.**

**1)**

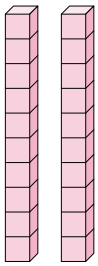

**2)**

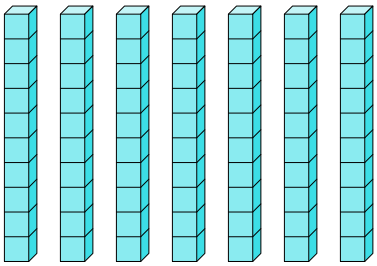

**3)**

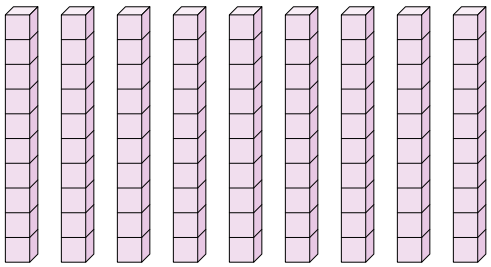

**4)**



**5)**

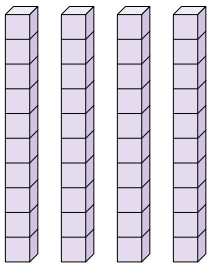

**6)**

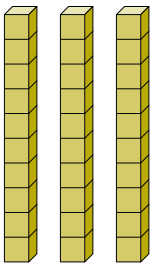

**7)**

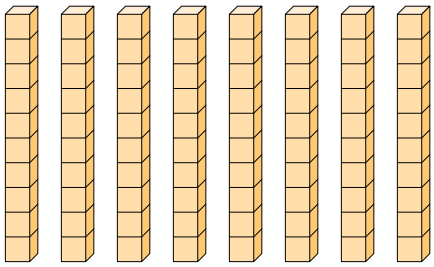

**8)**

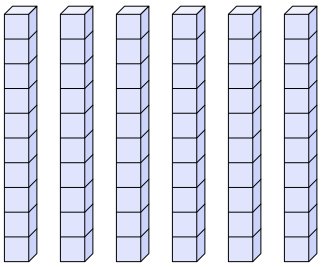

## Antworten

1. _____ _____
2. _____ _____
3. _____ _____
4. _____ _____
5. _____ _____
6. _____ _____
7. _____ _____
8. _____ _____



| 1-8 | 88 | 75 | 63 | 50 | 38 | 25 | 13 | 0 |
|---|---|---|---|---|---|---|---|---|

Zählen von Zehnergruppen

Name: **Lösungsschlüssel**

**Bestimme die Anzahl der Zehnergruppe. Dann ermittle die ganze Anzahl der kleinen Blocks.**

**1)**

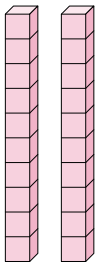

**2)**

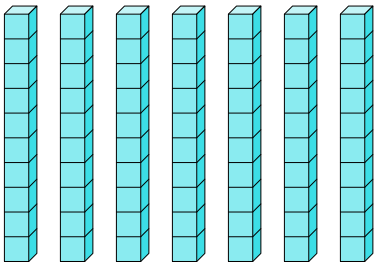

**3)**

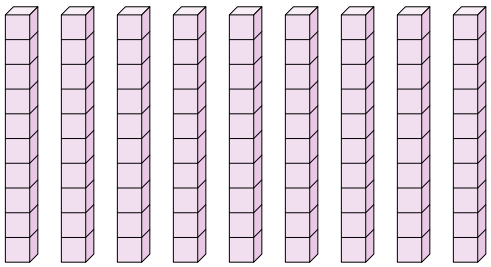

**4)**



**5)**

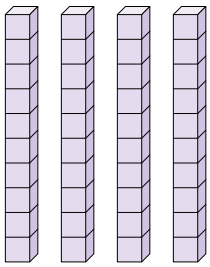

**6)**

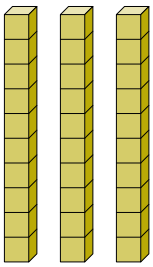

**7)**

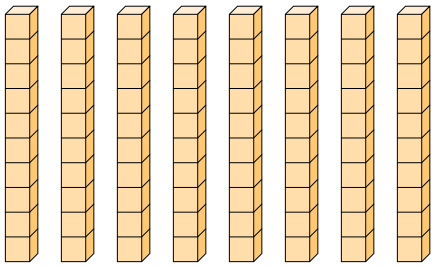

**8)**

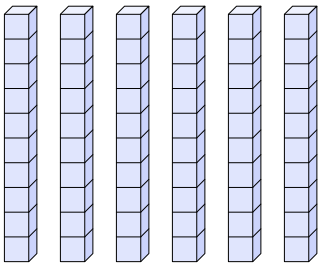

**Antworten**

| | | |
|---|---|---|
| 1. | 2 | 20 |
| 2. | 7 | 70 |
| 3. | 9 | 90 |
| 4. | 5 | 50 |
| 5. | 4 | 40 |
| 6. | 3 | 30 |
| 7. | 8 | 80 |
| 8. | 6 | 60 |



| 1-8 | 88 | 75 | 63 | 50 | 38 | 25 | 13 | 0 |
|---|---|---|---|---|---|---|---|---|

Zählen von Zehnergruppen Name:

**Bestimme die Anzahl der Zehnergruppe. Dann ermittle die ganze Anzahl der kleinen Blocks.**

**1)**

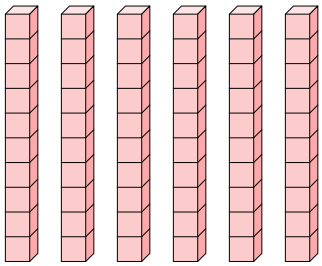

**2)**

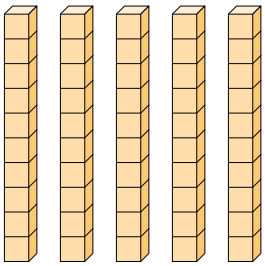

**3)**

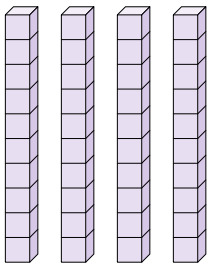

**4)**

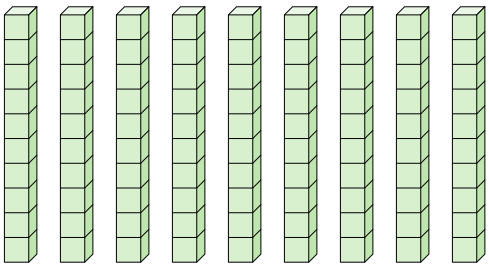

**5)**

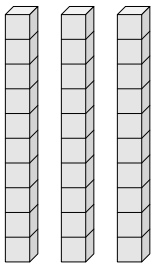

**6)**

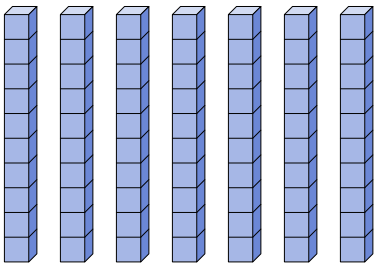

**7)**

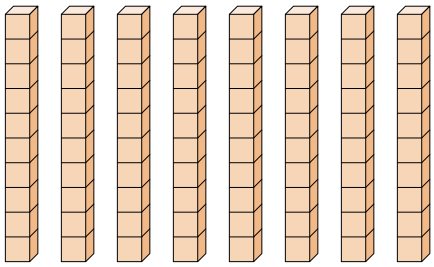

**8)**

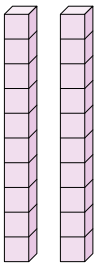

**Antworten**

1. _____ _____
2. _____ _____
3. _____ _____
4. _____ _____
5. _____ _____
6. _____ _____
7. _____ _____
8. _____ _____



| 1-8 | 88 | 75 | 63 | 50 | 38 | 25 | 13 | 0 |
|---|---|---|---|---|---|---|---|---|

Zählen von Zehnergruppen

Name: **Lösungsschlüssel**

**Bestimme die Anzahl der Zehnergruppe. Dann ermittle die ganze Anzahl der kleinen Blocks.**

**1)**

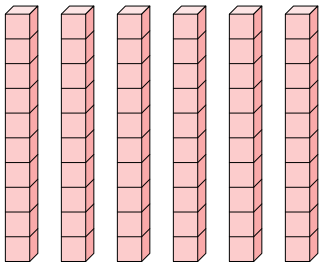

**2)**

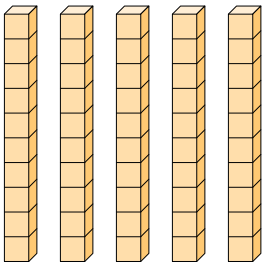

**3)**

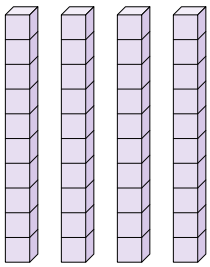

**4)**

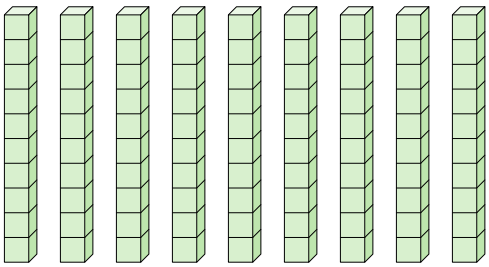

**5)**

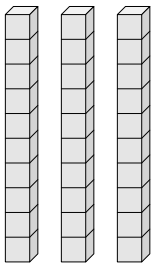

**6)**

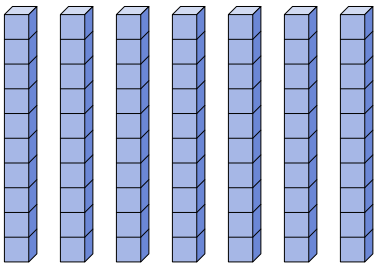

**7)**

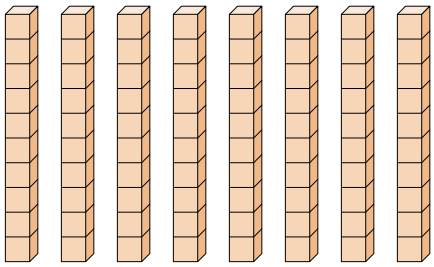

**8)**

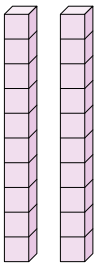

**Antworten**

| | | |
|---|---|---|
| 1. | 6 | 60 |
| 2. | 5 | 50 |
| 3. | 4 | 40 |
| 4. | 9 | 90 |
| 5. | 3 | 30 |
| 6. | 7 | 70 |
| 7. | 8 | 80 |
| 8. | 2 | 20 |



| 1-8 | 88 | 75 | 63 | 50 | 38 | 25 | 13 | 0 |
|---|---|---|---|---|---|---|---|---|

Zählen von Zehnergruppen Name:

**Bestimme die Anzahl der Zehnergruppe. Dann ermittle die ganze Anzahl der kleinen Blocks.**

**1)**

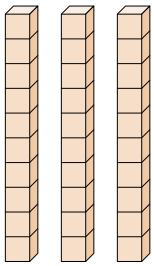

**2)**

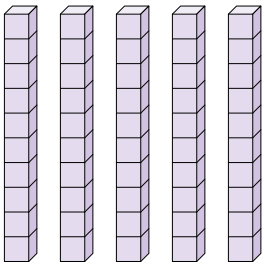

**3)**

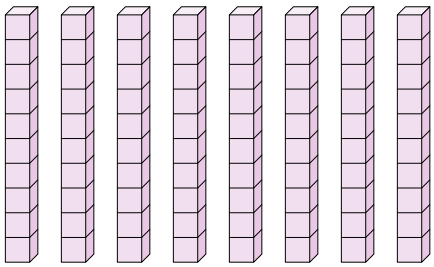

**4)**

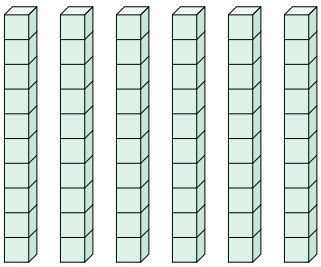

**5)**

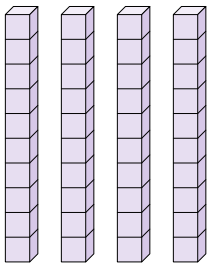

**6)**

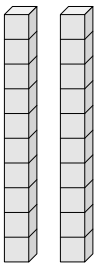

**7)**



**8)**



**Antworten**

1. _____ _____
2. _____ _____
3. _____ _____
4. _____ _____
5. _____ _____
6. _____ _____
7. _____ _____
8. _____ _____



| 1-8 | 88 | 75 | 63 | 50 | 38 | 25 | 13 | 0 |
|---|---|---|---|---|---|---|---|---|

Zählen von Zehnergruppen

Name: **Lösungsschlüssel**

**Bestimme die Anzahl der Zehnergruppe. Dann ermittle die ganze Anzahl der kleinen Blocks.**

**1)**

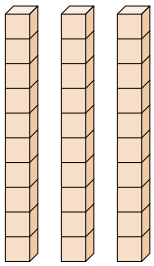

**2)**

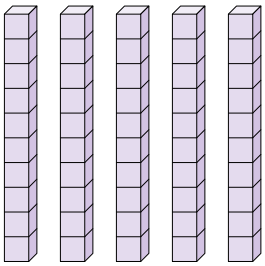

**3)**

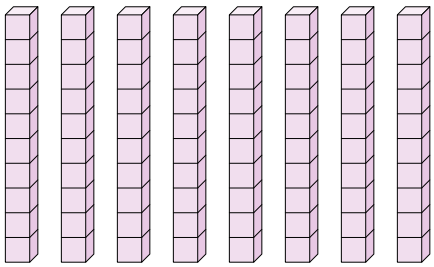

**4)**

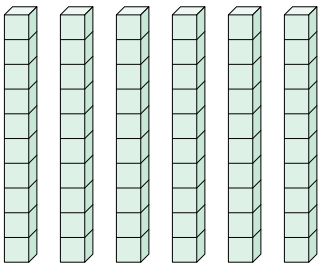

**5)**

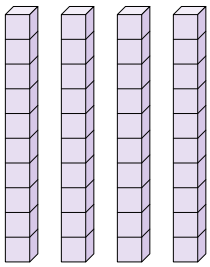

**6)**

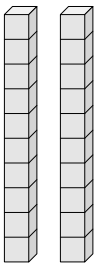

**7)**



**8)**



**Antworten**

| | | |
|---|---|---|
| 1. | 3 | 30 |
| 2. | 5 | 50 |
| 3. | 8 | 80 |
| 4. | 6 | 60 |
| 5. | 4 | 40 |
| 6. | 2 | 20 |
| 7. | 7 | 70 |
| 8. | 9 | 90 |



| 1-8 | 88 | 75 | 63 | 50 | 38 | 25 | 13 | 0 |
|---|---|---|---|---|---|---|---|---|

Zählen von Zehnergruppen Name:

**Bestimme die Anzahl der Zehnergruppe. Dann ermittle die ganze Anzahl der kleinen Blocks.**

**1)**

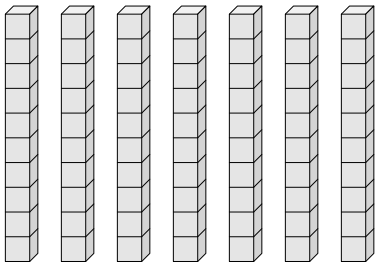

**2)**

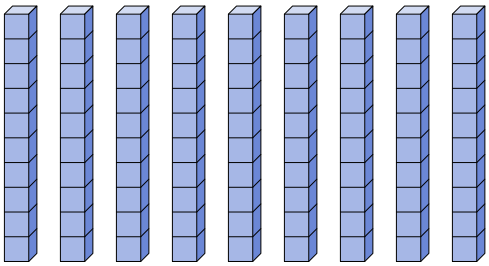

**3)**

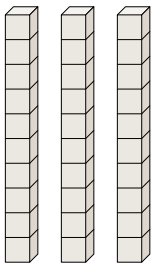

**4)**

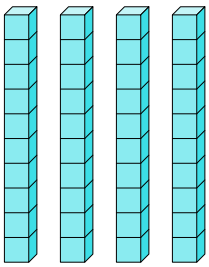

**5)**

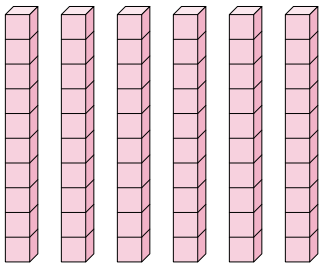

**6)**

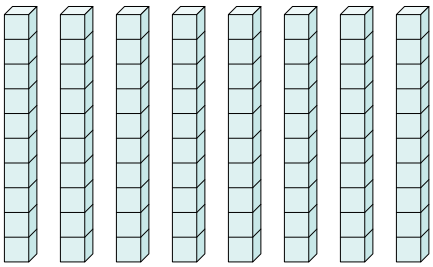

**7)**

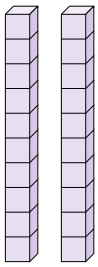

**8)**



**Antworten**

1. _____ _____
2. _____ _____
3. _____ _____
4. _____ _____
5. _____ _____
6. _____ _____
7. _____ _____
8. _____ _____



| 1-8 | 88 | 75 | 63 | 50 | 38 | 25 | 13 | 0 |
|---|---|---|---|---|---|---|---|---|

Zählen von Zehnergruppen

Name: **Lösungsschlüssel**

**Bestimme die Anzahl der Zehnergruppe. Dann ermittle die ganze Anzahl der kleinen Blocks.**

**1)**

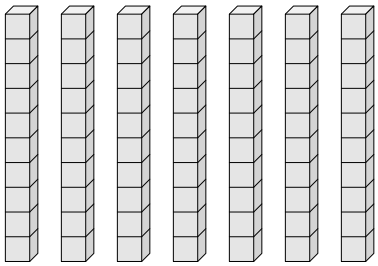

**2)**

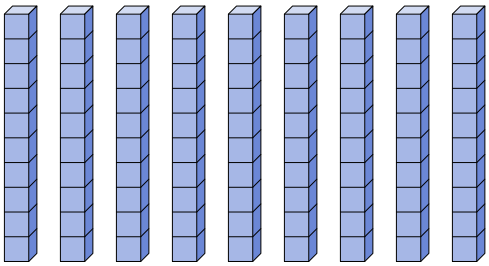

**3)**

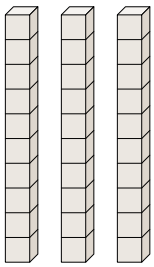

**4)**

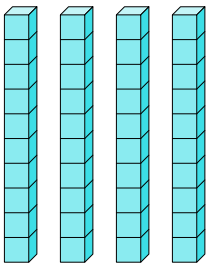

**5)**

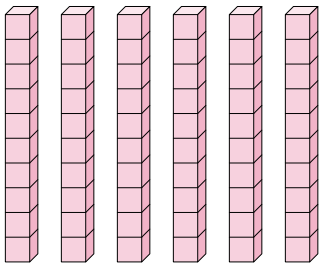

**6)**

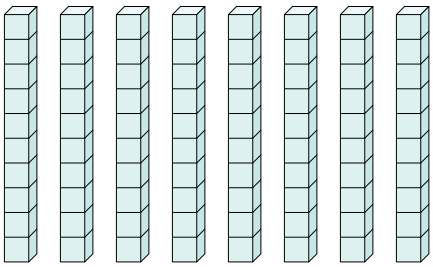

**7)**

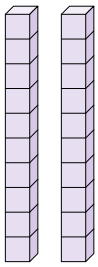

**8)**



**Antworten**

| | | |
|---|---|---|
| 1. | 7 | 70 |
| 2. | 9 | 90 |
| 3. | 3 | 30 |
| 4. | 4 | 40 |
| 5. | 6 | 60 |
| 6. | 8 | 80 |
| 7. | 2 | 20 |
| 8. | 5 | 50 |



| 1-8 | 88 | 75 | 63 | 50 | 38 | 25 | 13 | 0 |
|---|---|---|---|---|---|---|---|---|

Zählen von Zehnergruppen Name:

**Bestimme die Anzahl der Zehnergruppe. Dann ermittle die ganze Anzahl der kleinen Blocks.**

**1)**

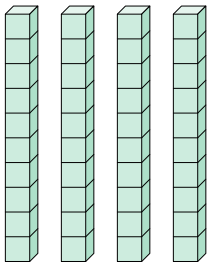

**2)**

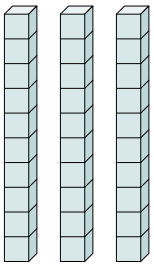

**3)**

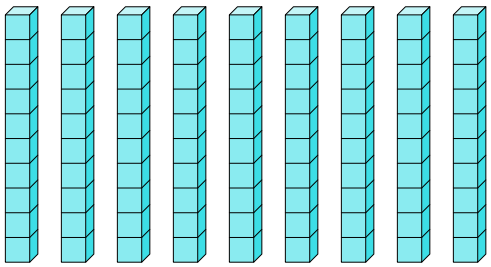

**4)**

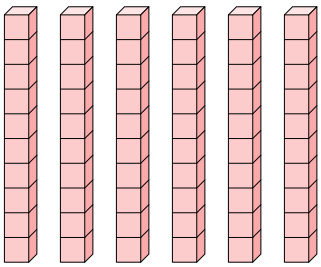

**5)**

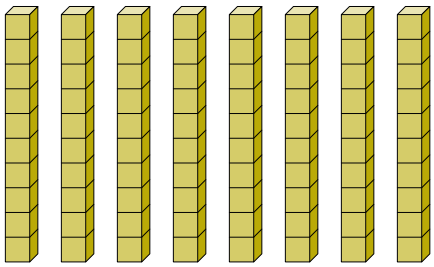

**6)**

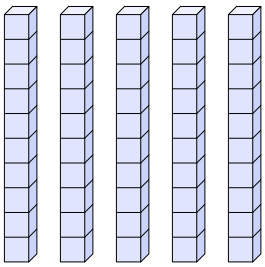

**7)**



**8)**

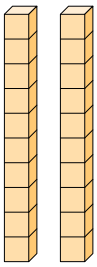

**Antworten**

1. _____ _____
2. _____ _____
3. _____ _____
4. _____ _____
5. _____ _____
6. _____ _____
7. _____ _____
8. _____ _____



| 1-8 | 88 | 75 | 63 | 50 | 38 | 25 | 13 | 0 |
|---|---|---|---|---|---|---|---|---|

Zählen von Zehnergruppen

Name: **Lösungsschlüssel**

**Bestimme die Anzahl der Zehnergruppe. Dann ermittle die ganze Anzahl der kleinen Blocks.**

**1)**

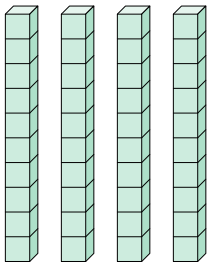

**2)**

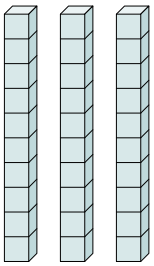

**3)**

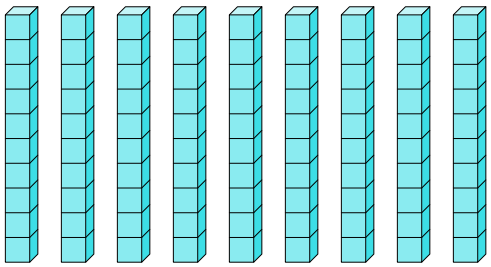

**4)**

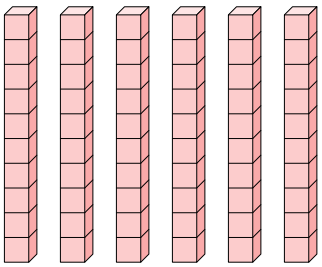

**5)**

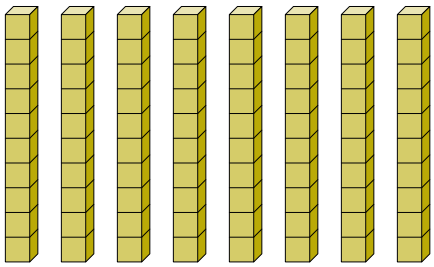

**6)**

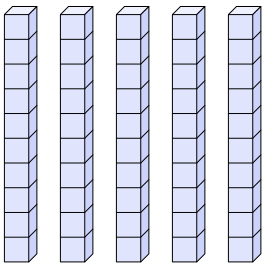

**7)**



**8)**

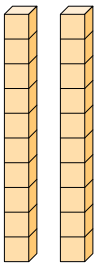

**Antworten**

| | | |
|---|---|---|
| 1. | 4 | 40 |
| 2. | 3 | 30 |
| 3. | 9 | 90 |
| 4. | 6 | 60 |
| 5. | 8 | 80 |
| 6. | 5 | 50 |
| 7. | 7 | 70 |
| 8. | 2 | 20 |



| 1-8 | 88 | 75 | 63 | 50 | 38 | 25 | 13 | 0 |
|---|---|---|---|---|---|---|---|---|

Zählen von Zehnergruppen Name:

**Bestimme die Anzahl der Zehnergruppe. Dann ermittle die ganze Anzahl der kleinen Blocks.**

**1)**



**2)**

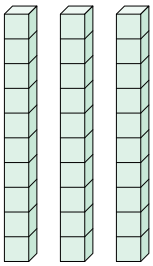

**3)**

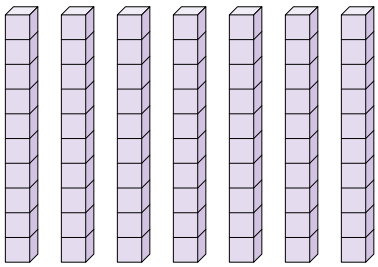

**4)**

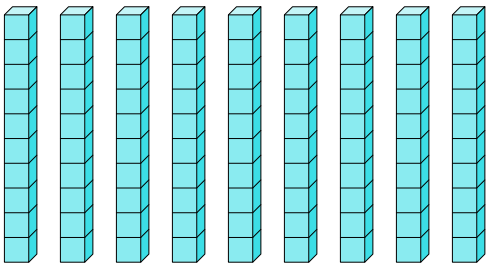

**5)**

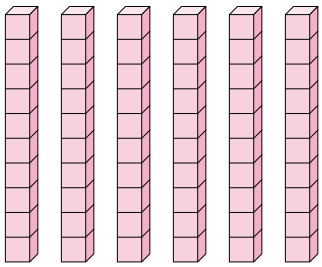

**6)**



**7)**

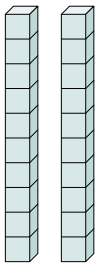

**8)**

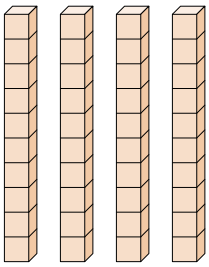

**Antworten**

1. _____ _____
2. _____ _____
3. _____ _____
4. _____ _____
5. _____ _____
6. _____ _____
7. _____ _____
8. _____ _____



| 1-8 | 88 | 75 | 63 | 50 | 38 | 25 | 13 | 0 |
|---|---|---|---|---|---|---|---|---|

Zählen von Zehnergruppen

Name: **Lösungsschlüssel**

**Bestimme die Anzahl der Zehnergruppe. Dann ermittle die ganze Anzahl der kleinen Blocks.**

**1)**



**2)**

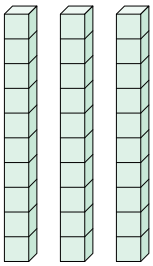

**3)**

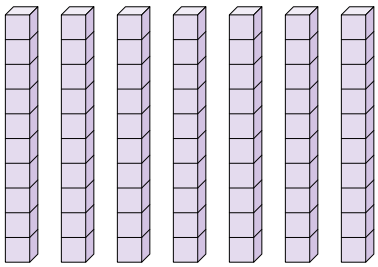

**4)**

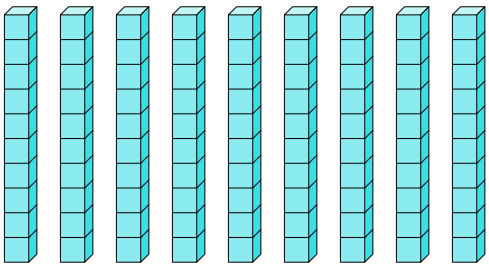

**5)**

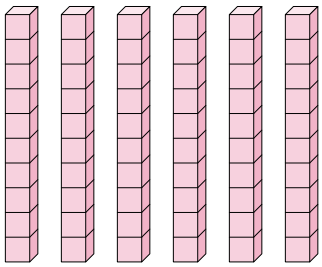

**6)**



**7)**

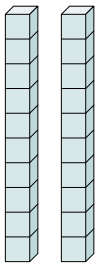

**8)**

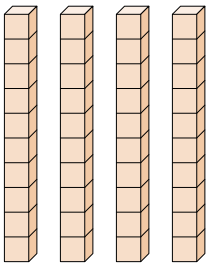

**Antworten**

| | | |
|---|---|---|
| 1. | 8 | 80 |
| 2. | 3 | 30 |
| 3. | 7 | 70 |
| 4. | 9 | 90 |
| 5. | 6 | 60 |
| 6. | 5 | 50 |
| 7. | 2 | 20 |
| 8. | 4 | 40 |



| 1-8 | 88 | 75 | 63 | 50 | 38 | 25 | 13 | 0 |
|---|---|---|---|---|---|---|---|---|

Zählen von Zehnergruppen Name:

**Bestimme die Anzahl der Zehnergruppe. Dann ermittle die ganze Anzahl der kleinen Blocks.**

**1)**

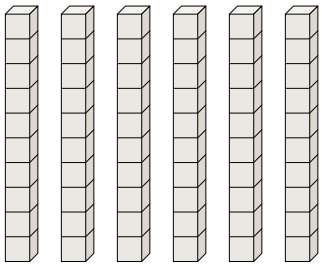

**2)**

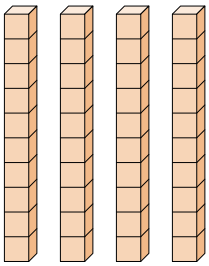

**3)**

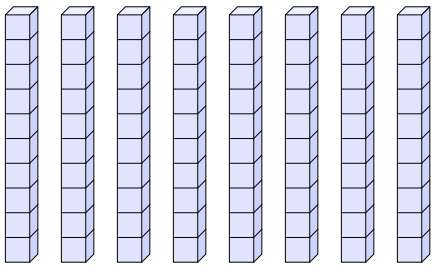

**4)**

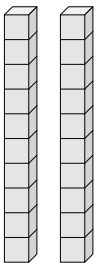

**5)**

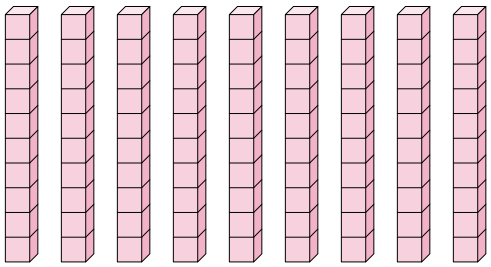

**6)**



**7)**

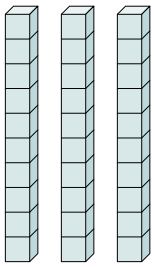

**8)**

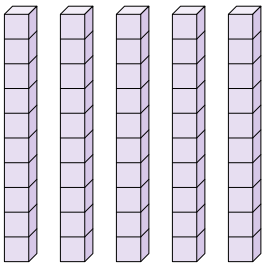

**Antworten**

1. _____ _____
2. _____ _____
3. _____ _____
4. _____ _____
5. _____ _____
6. _____ _____
7. _____ _____
8. _____ _____



| 1-8 | 88 | 75 | 63 | 50 | 38 | 25 | 13 | 0 |
|---|---|---|---|---|---|---|---|---|

Zählen von Zehnergruppen

Name: **Lösungsschlüssel**

**Bestimme die Anzahl der Zehnergruppe. Dann ermittle die ganze Anzahl der kleinen Blocks.**

**1)**

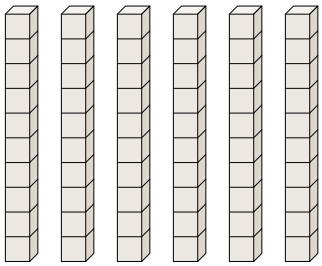

**2)**

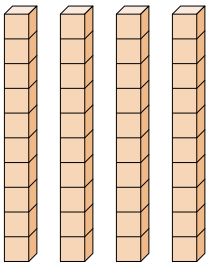

**3)**

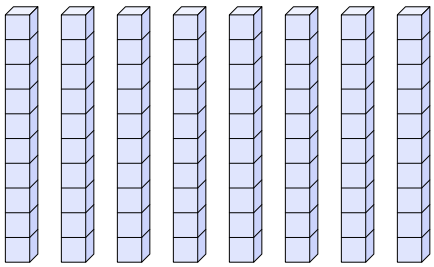

**4)**

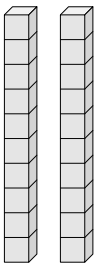

**5)**

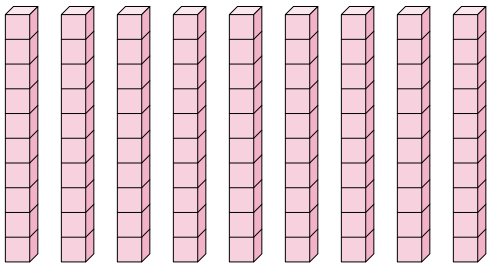

**6)**



**7)**

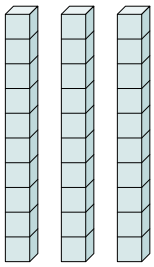

**8)**

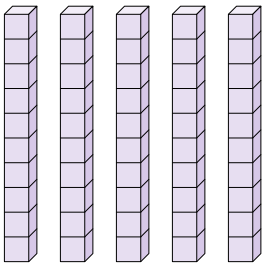

**Antworten**

| | | |
|---|---|---|
| 1. | 6 | 60 |
| 2. | 4 | 40 |
| 3. | 8 | 80 |
| 4. | 2 | 20 |
| 5. | 9 | 90 |
| 6. | 7 | 70 |
| 7. | 3 | 30 |
| 8. | 5 | 50 |



| 1-8 | 88 | 75 | 63 | 50 | 38 | 25 | 13 | 0 |
|---|---|---|---|---|---|---|---|---|

Zählen von Zehnergruppen Name:

**Bestimme die Anzahl der Zehnergruppe. Dann ermittle die ganze Anzahl der kleinen Blocks.**

**1)**



**2)**

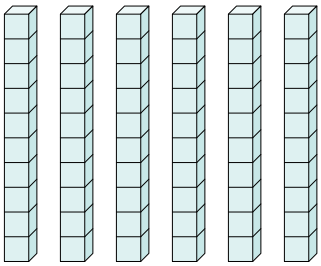

**3)**

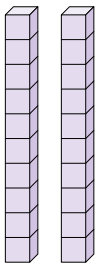

**4)**

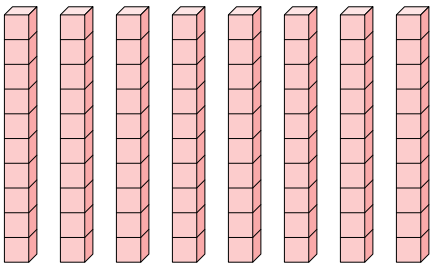

**5)**

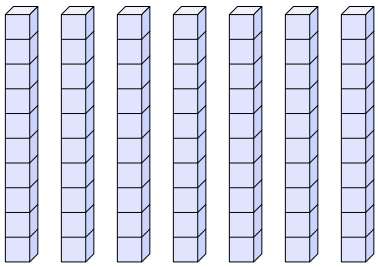

**6)**

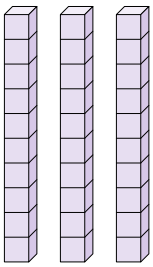

**7)**

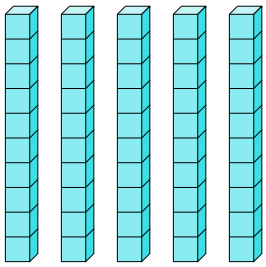

**8)**

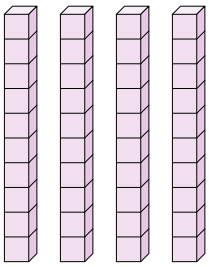

**Antworten**

1. _____ _____
2. _____ _____
3. _____ _____
4. _____ _____
5. _____ _____
6. _____ _____
7. _____ _____
8. _____ _____



| 1-8 | 88 | 75 | 63 | 50 | 38 | 25 | 13 | 0 |
|---|---|---|---|---|---|---|---|---|

Zählen von Zehnergruppen

Name: **Lösungsschlüssel**

**Bestimme die Anzahl der Zehnergruppe. Dann ermittle die ganze Anzahl der kleinen Blocks.**

**1)**



**2)**

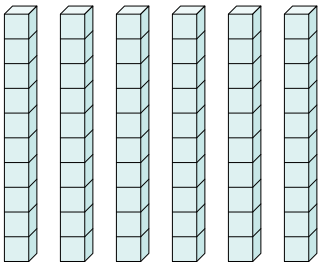

**3)**

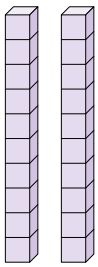

**4)**

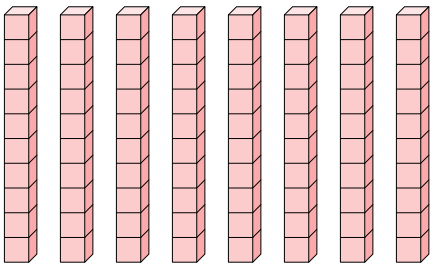

**5)**

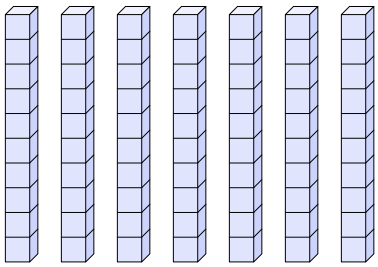

**6)**

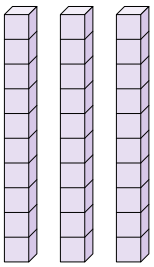

**7)**

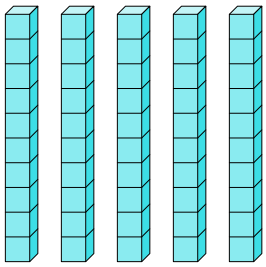

**8)**

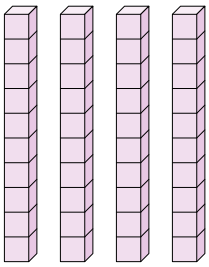

**Antworten**

| | | |
|---|---|---|
| 1. | 9 | 90 |
| 2. | 6 | 60 |
| 3. | 2 | 20 |
| 4. | 8 | 80 |
| 5. | 7 | 70 |
| 6. | 3 | 30 |
| 7. | 5 | 50 |
| 8. | 4 | 40 |



| 1-8 | 88 | 75 | 63 | 50 | 38 | 25 | 13 | 0 |
|---|---|---|---|---|---|---|---|---|

Zählen von Zehnergruppen Name:

**Bestimme die Anzahl der Zehnergruppe. Dann ermittle die ganze Anzahl der kleinen Blocks.**

**1)**



**2)**

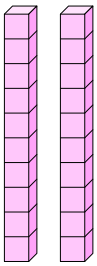

**3)**

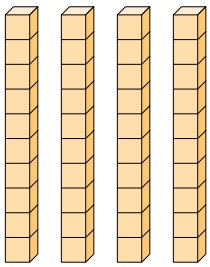

**4)**

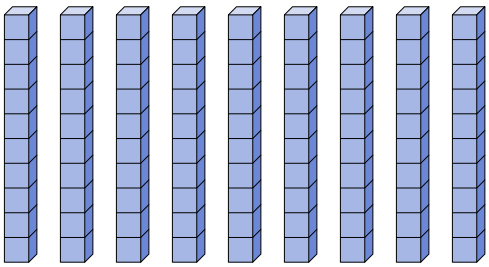

**5)**

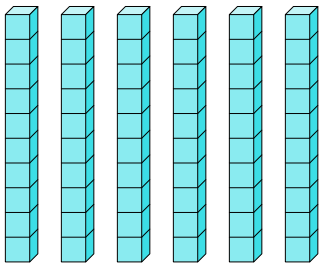

**6)**

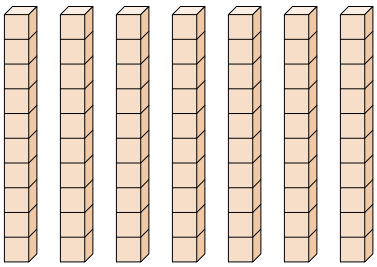

**7)**

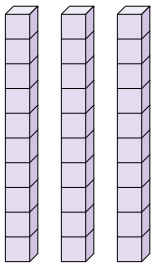

**8)**

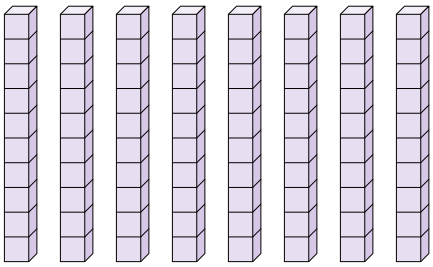

**Antworten**

1. _____ _____
2. _____ _____
3. _____ _____
4. _____ _____
5. _____ _____
6. _____ _____
7. _____ _____
8. _____ _____



| 1-8 | 88 | 75 | 63 | 50 | 38 | 25 | 13 | 0 |
|---|---|---|---|---|---|---|---|---|

Zählen von Zehnergruppen

Name: **Lösungsschlüssel**

**Bestimme die Anzahl der Zehnergruppe. Dann ermittle die ganze Anzahl der kleinen Blocks.**

**1)**



**2)**

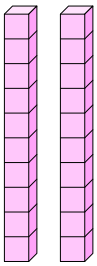

**3)**

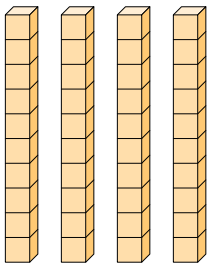

**4)**

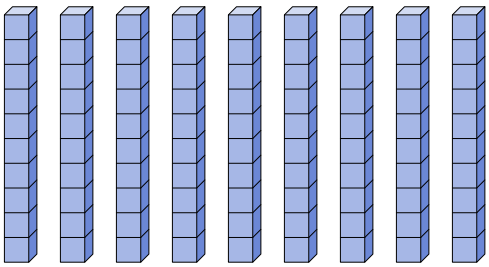

**5)**

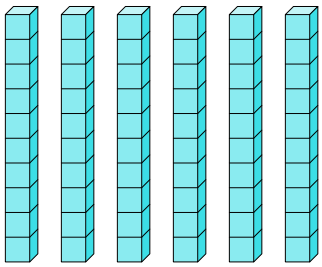

**6)**

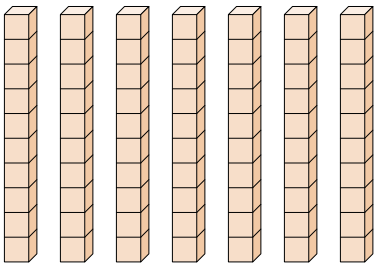

**7)**

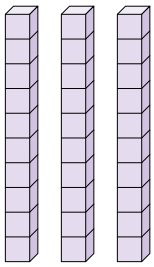

**8)**

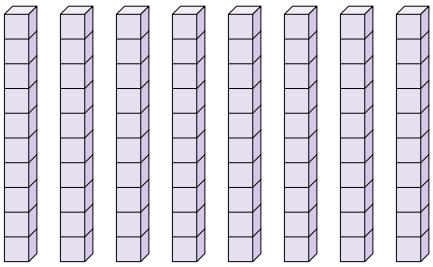

**Antworten**

| | | |
|---|---|---|
| 1. | 5 | 50 |
| 2. | 2 | 20 |
| 3. | 4 | 40 |
| 4. | 9 | 90 |
| 5. | 6 | 60 |
| 6. | 7 | 70 |
| 7. | 3 | 30 |
| 8. | 8 | 80 |



| 1-8 | 88 | 75 | 63 | 50 | 38 | 25 | 13 | 0 |
|---|---|---|---|---|---|---|---|---|

Zählen von Zehnergruppen Name:

**Bestimme die Anzahl der Zehnergruppe. Dann ermittle die ganze Anzahl der kleinen Blocks.**

**1)**

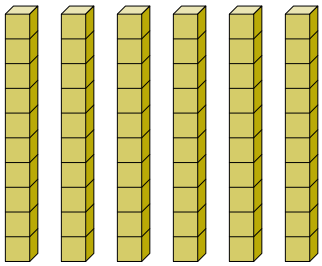

**2)**

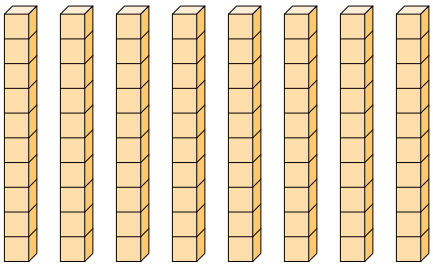

**3)**

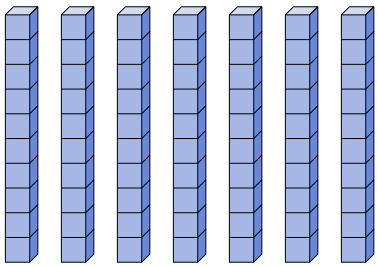

**4)**



**5)**

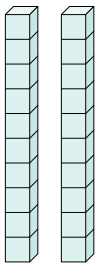

**6)**

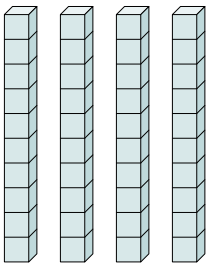

**7)**

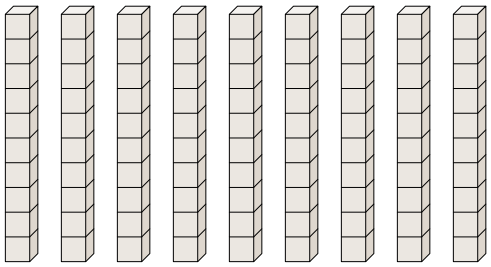

**8)**

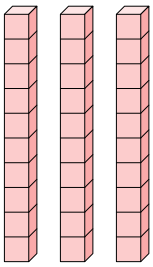

**Antworten**

1. _____ _____
2. _____ _____
3. _____ _____
4. _____ _____
5. _____ _____
6. _____ _____
7. _____ _____
8. _____ _____



| 1-8 | 88 | 75 | 63 | 50 | 38 | 25 | 13 | 0 |
|---|---|---|---|---|---|---|---|---|

Zählen von Zehnergruppen

Name: **Lösungsschlüssel**

**Bestimme die Anzahl der Zehnergruppe. Dann ermittle die ganze Anzahl der kleinen Blocks.**

**1)**

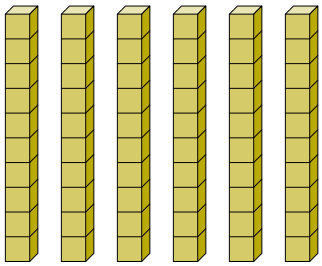

**2)**

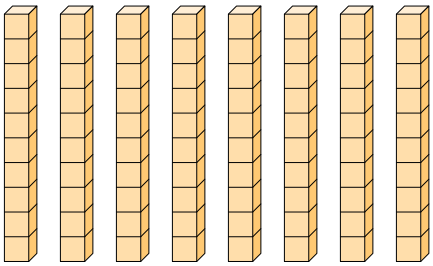

**3)**

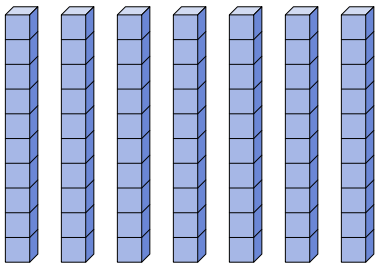

**4)**



**5)**

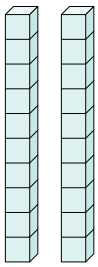

**6)**

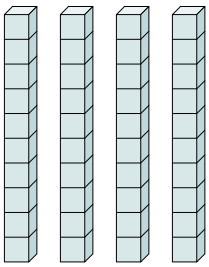

**7)**

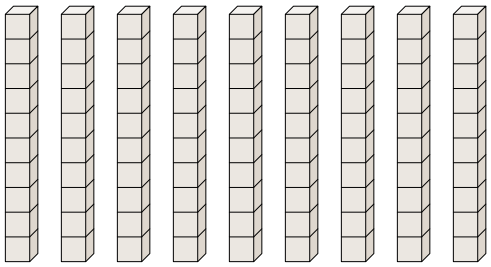

**8)**

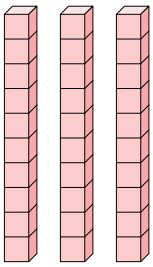

**Antworten**

| | | |
|---|---|---|
| 1. | 6 | 60 |
| 2. | 8 | 80 |
| 3. | 7 | 70 |
| 4. | 5 | 50 |
| 5. | 2 | 20 |
| 6. | 4 | 40 |
| 7. | 9 | 90 |
| 8. | 3 | 30 |



| 1-8 | 88 | 75 | 63 | 50 | 38 | 25 | 13 | 0 |
|---|---|---|---|---|---|---|---|---|