Bestimmung des Umfangs & der Fläche Name:

Bestimme den Umfang und die Fläche jeder Figur. Jede Figur ist in Zentimeter (cm). Nicht maßstäblich.

1)

2)

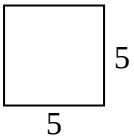

3)

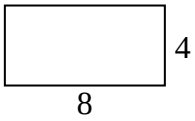

4)



5)

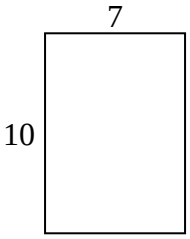

6)

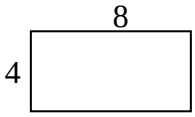

7)

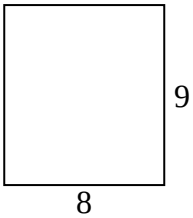

8)

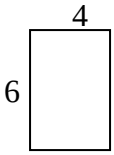

9)

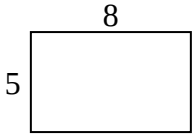

10)



11)

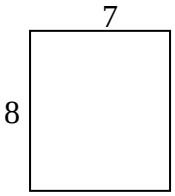

12)

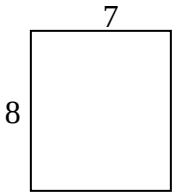

13)

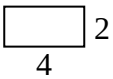

14)

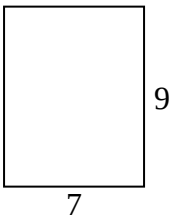

15)

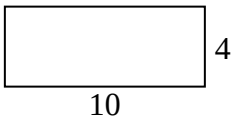

Antworten

1. _____ _____
2. _____ _____
3. _____ _____
4. _____ _____
5. _____ _____
6. _____ _____
7. _____ _____
8. _____ _____
9. _____ _____
10. _____ _____
11. _____ _____
12. _____ _____
13. _____ _____
14. _____ _____
15. _____ _____

1-10	93	87	80	73	67	60	53	47	40	33
11-15	27	20	13	7	0					

Bestimmung des Umfangs & der Fläche Name: **Lösungsschlüssel**

Bestimme den Umfang und die Fläche jeder Figur. Jede Figur ist in Zentimeter (cm). Nicht maßstäblich.

1)

2)

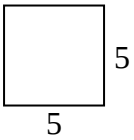

3)

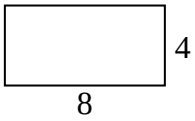

4)



5)

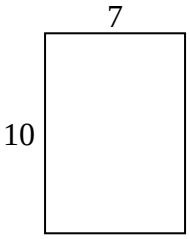

6)

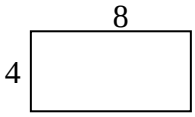

7)

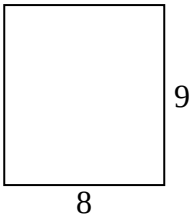

8)

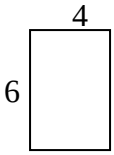

9)

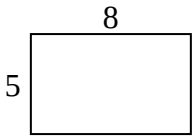

10)



11)

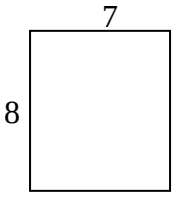

12)

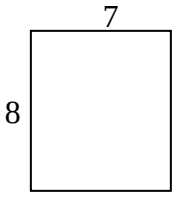

13)

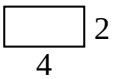

14)

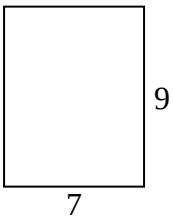

15)

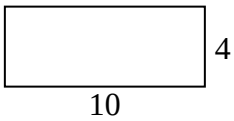

Antworten

1.	10	6
2.	20	25
3.	24	32
4.	26	36
5.	34	70
6.	24	32
7.	34	72
8.	20	24
9.	26	40
10.	28	40
11.	30	56
12.	30	56
13.	12	8
14.	32	63
15.	28	40

1-10	93	87	80	73	67	60	53	47	40	33
11-15	27	20	13	7	0					