Berechne die Oberfläche jeder Figur.

Bsp)

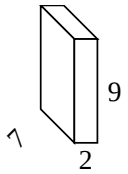

1)

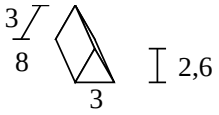

2)

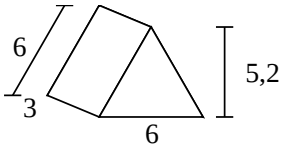

3)

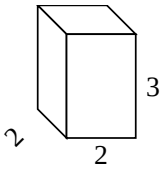

4)

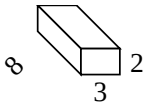

5)

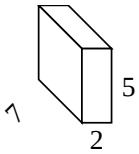

6)

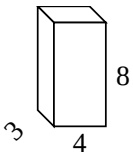

7)

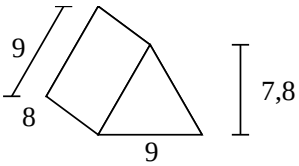

8)

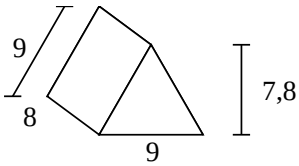

Antworten

Bsp. **190 cm²**

1. _____
2. _____
3. _____
4. _____
5. _____
6. _____
7. _____
8. _____

1-8	88	75	63	50	38	25	13	0

Berechne die Oberfläche jeder Figur.

Bsp)

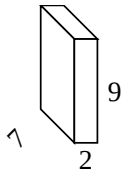

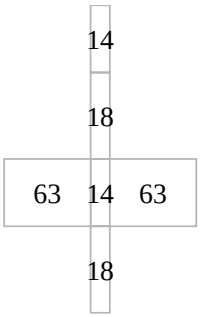

1)

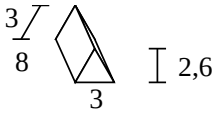

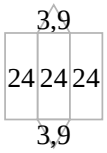

2)

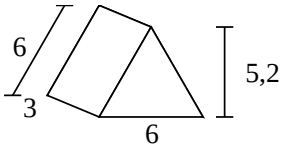

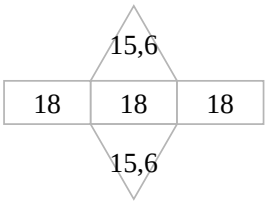

3)

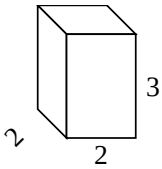

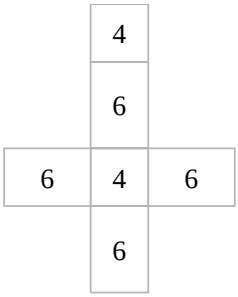

4)

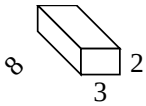

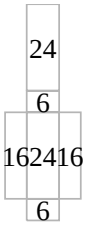

5)

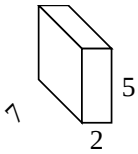

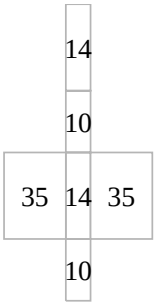

6)

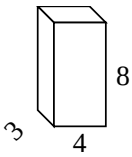

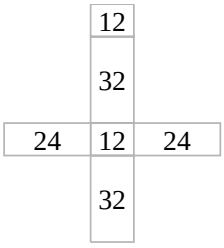

7)

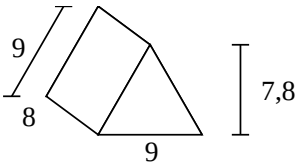

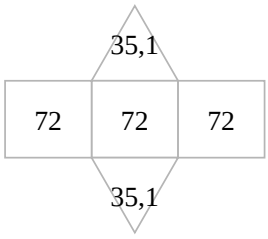

8)

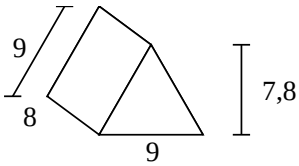

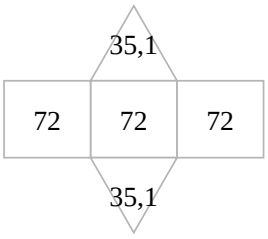

Antworten

Bsp.	190 cm^2
1.	79,8 cm^2
2.	85,2 cm^2
3.	32 cm^2
4.	92 cm^2
5.	118 cm^2
6.	136 cm^2
7.	286,2 cm^2
8.	286,2 cm^2

1-8	88	75	63	50	38	25	13	0