Flächenberechnung mit Fliesen

Name:

Berechne die Flächen, indem du die Rechtecke in Fliesen aufteilst. Die erste Aufgabe zeigt, wie es gemacht wird.

1)

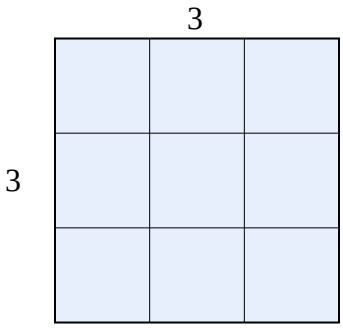

2)

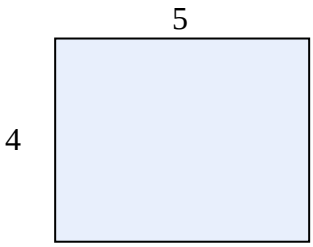

3)

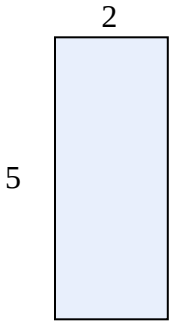

4)

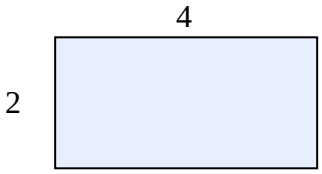

5)

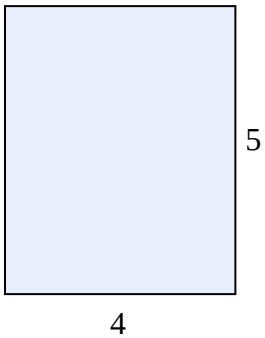

6)

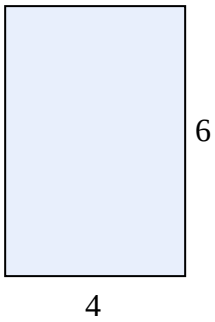

7)



8)

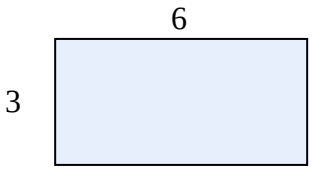

9)

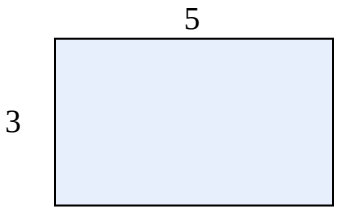

10)

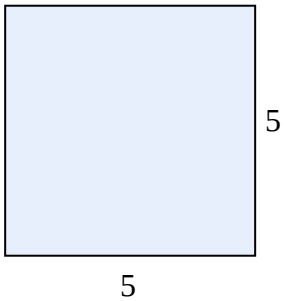

Antworten

1. _____
2. _____
3. _____
4. _____
5. _____
6. _____
7. _____
8. _____
9. _____
10. _____

1-10	90	80	70	60	50	40	30	20	10	0

Flächenberechnung mit Fliesen

Name: **Lösungsschlüssel**

Berechne die Flächen, indem du die Rechtecke in Fliesen aufteilst. Die erste Aufgabe zeigt, wie es gemacht wird.

1)

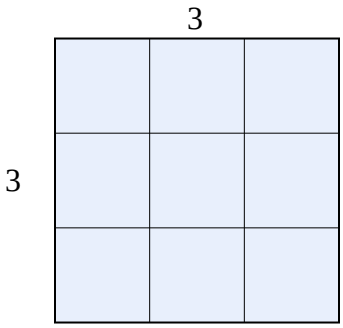

2)

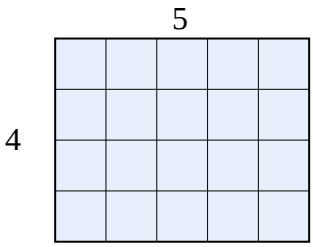

3)

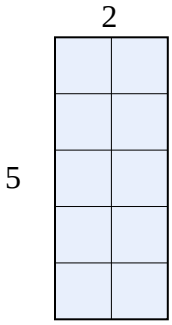

4)

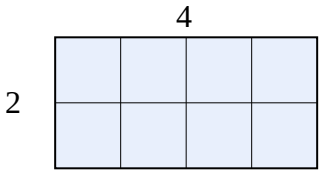

5)

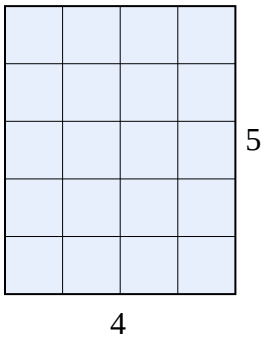

6)

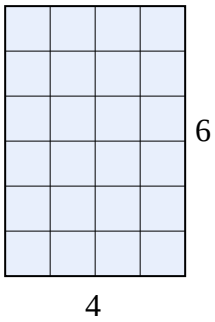

7)

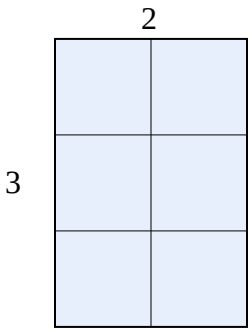

8)

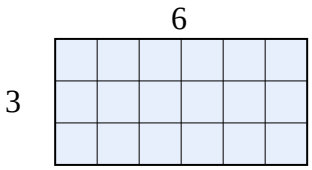

9)

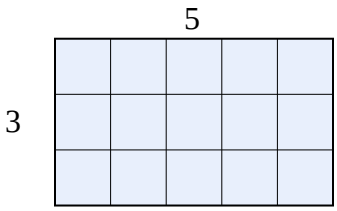

10)

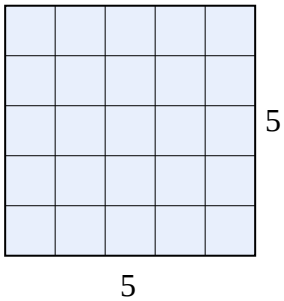

Antworten

1. **9**
2. **20**
3. **10**
4. **8**
5. **20**
6. **24**
7. **6**
8. **18**
9. **15**
10. **25**