Kreisfläche und Kreisumfang Name:

Berechne die Kreisfläche und den Kreisumfang jedes Kreises. Die Kreise sind nicht maßstäblich.

1)

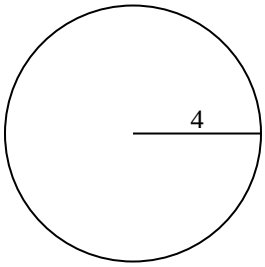

2)

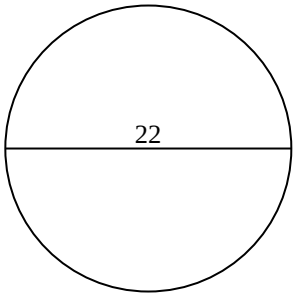

3)

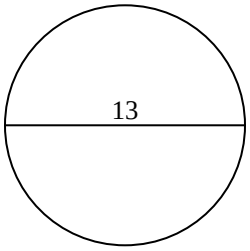

4)

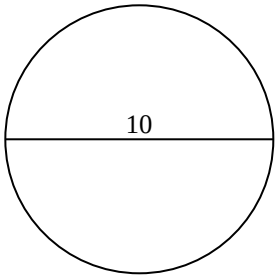

5)

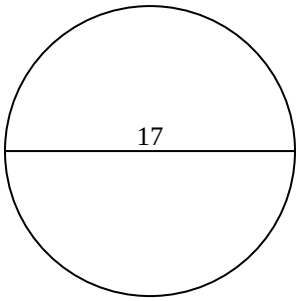

6)

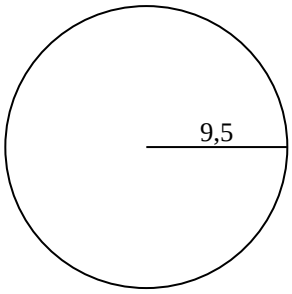

7)

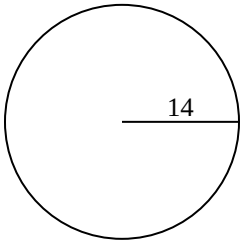

8)

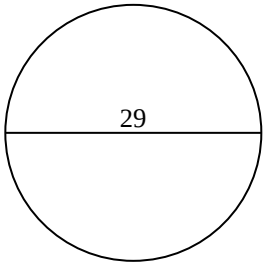

9)

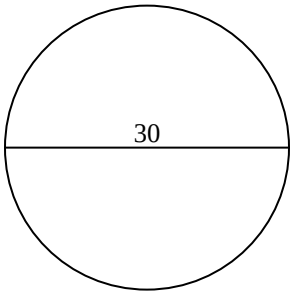

10)

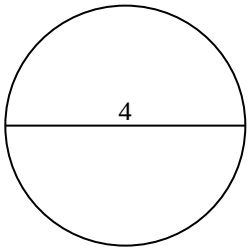

Antworten

1. _____ _____
2. _____ _____
3. _____ _____
4. _____ _____
5. _____ _____
6. _____ _____
7. _____ _____
8. _____ _____
9. _____ _____
10. _____ _____

1-10	90	80	70	60	50	40	30	20	10	0

Kreisfläche und Kreisumfang

Name: **Lösungsschlüssel**

Berechne die Kreisfläche und den Kreisumfang jedes Kreises. Die Kreise sind nicht maßstäblich.

1)

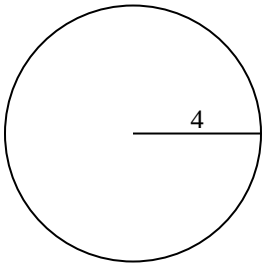

2)

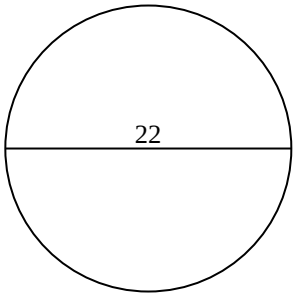

3)

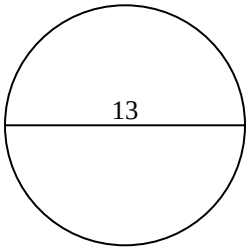

4)

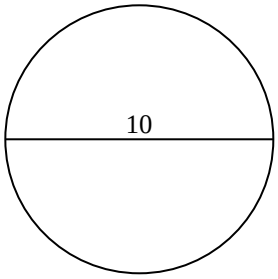

5)

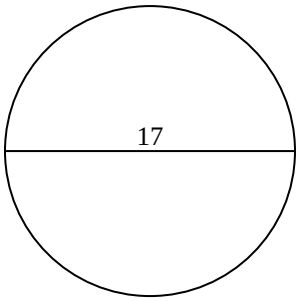

6)

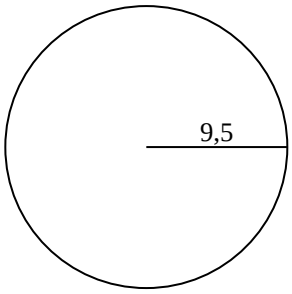

7)

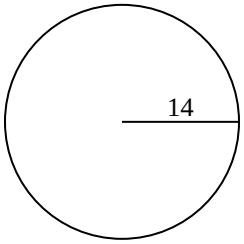

8)

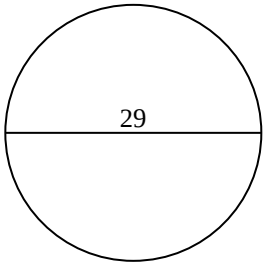

9)

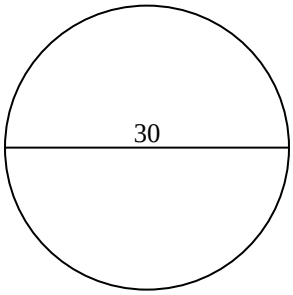

10)

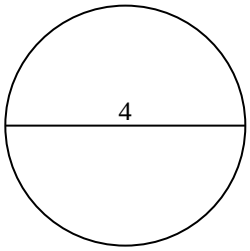

Antworten

1.	50,3	25,1
2.	380,1	69,1
3.	132,7	40,8
4.	78,5	31,4
5.	227	53,4
6.	283,5	59,7
7.	615,8	88
8.	660,5	91,1
9.	706,9	94,2
10.	12,6	12,6

1-10	90	80	70	60	50	40	30	20	10	0

Kreisfläche und Kreisumfang Name:

Berechne die Kreisfläche und den Kreisumfang jedes Kreises. Die Kreise sind nicht maßstäblich.

25,1	227	78,5	615,8	91,1
380,1	31,4	132,7	706,9	59,7
50,3	69,1	88	53,4	660,5
283,5	40,8	94,2		

1)

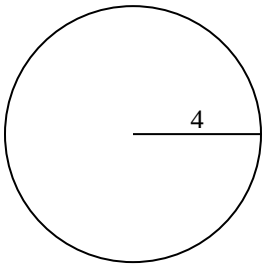

2)

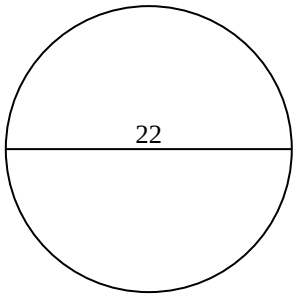

3)

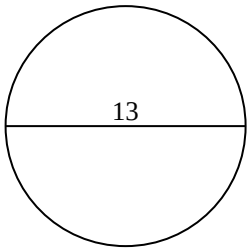

4)

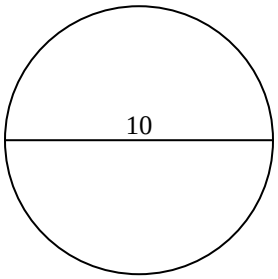

5)

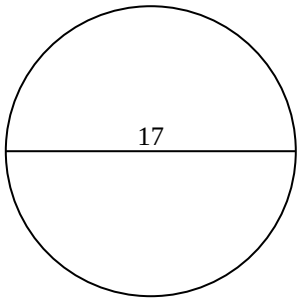

6)

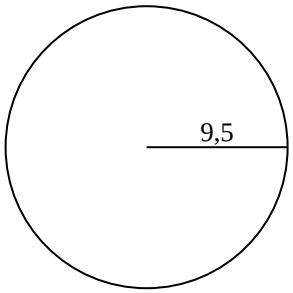

7)

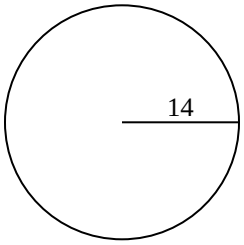

8)

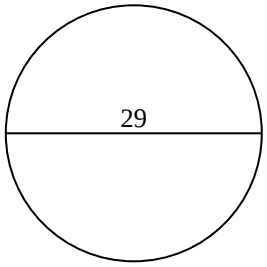

9)

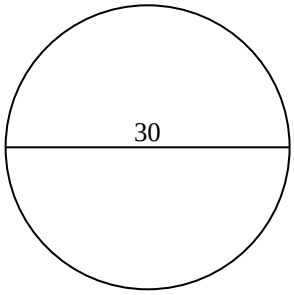

Antworten

1. _____ _____
2. _____ _____
3. _____ _____
4. _____ _____
5. _____ _____
6. _____ _____
7. _____ _____
8. _____ _____
9. _____ _____

1-9	89	78	67	56	44	33	22	11	0