Identifizieren des Volumens einer Box

Name:

Bestimmen Sie das Volumen jeder Box. Jeder Block ist 1 Kubikeinheit (u 3).

1)

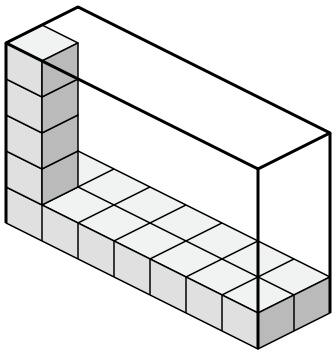

2)

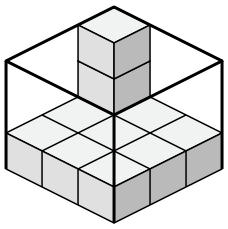

3)

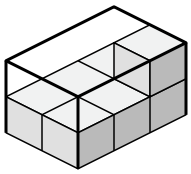

4)

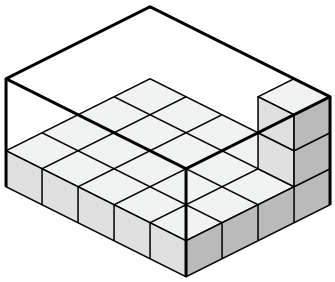

5)

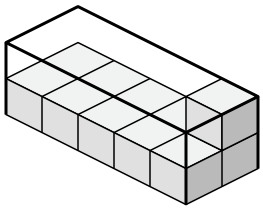

6)

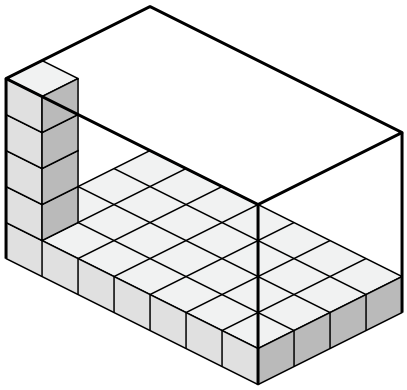

7)

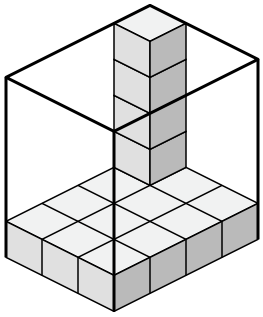

8)

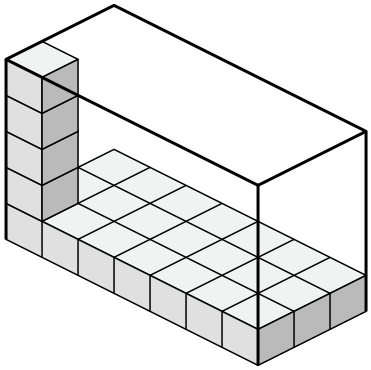

Antworten

1. _____
2. _____
3. _____
4. _____
5. _____
6. _____
7. _____
8. _____

1-8	88	75	63	50	38	25	13	0

Identifizieren des Volumens einer Box

Name: **Lösungsschlüssel**

Bestimmen Sie das Volumen jeder Box. Jeder Block ist 1 Kubikeinheit (u 3).

1)

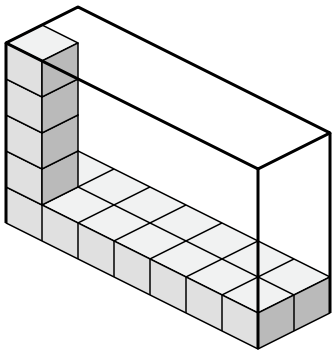

2)

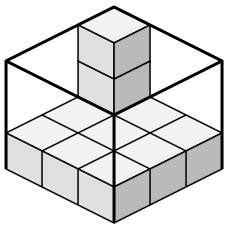

3)

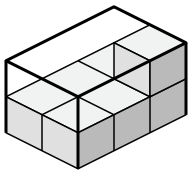

4)

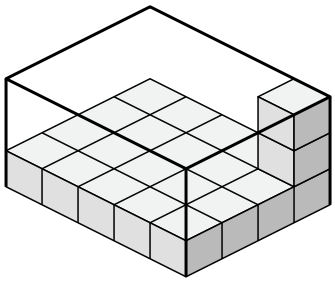

5)

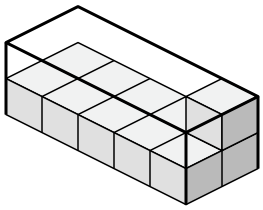

6)

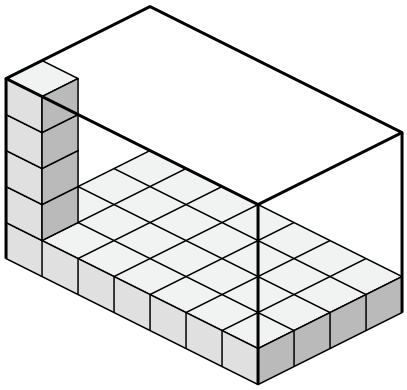

7)

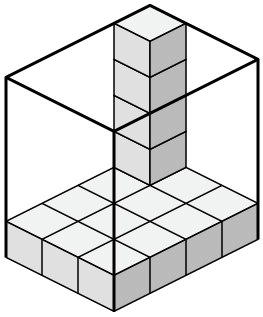

8)

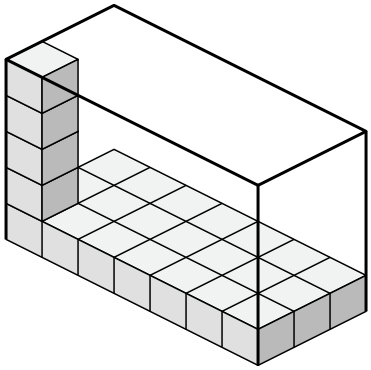

Antworten

1. **70 u^3**
2. **27 u^3**
3. **12 u^3**
4. **60 u^3**
5. **20 u^3**
6. **140 u^3**
7. **60 u^3**
8. **105 u^3**

1-8	88	75	63	50	38	25	13	0