Kleinere Einheiten identifizieren

Name:

Bestimme die Anzahl der kleinen Teilstücke, die aus dem größeren Stück gemacht werden können.

Bsp) $5\frac{2}{3}$

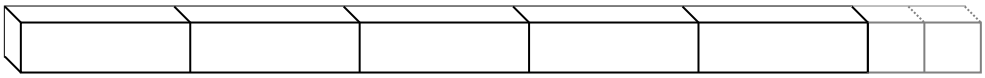

1) $3\frac{3}{4}$

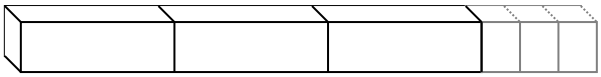

2) $9\frac{1}{5}$

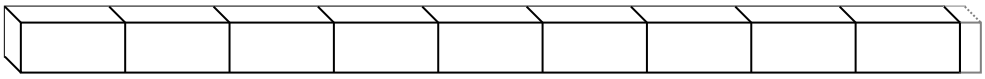

3) $1\frac{2}{3}$



4) $6\frac{1}{3}$

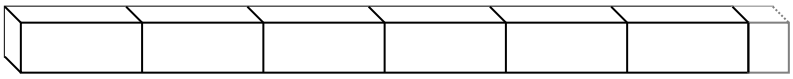

5) $1\frac{1}{4}$



6) $1\frac{4}{5}$

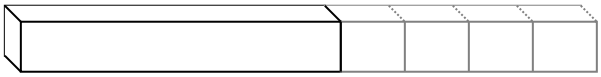

7) $9\frac{2}{5}$

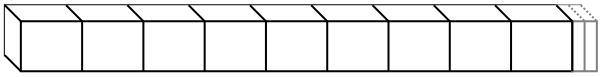

8) $8\frac{1}{2}$

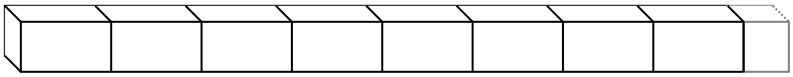

9) $9\frac{1}{2}$

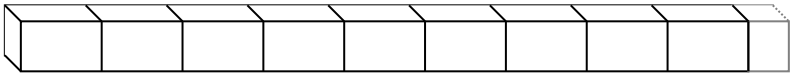

10) $9\frac{3}{4}$

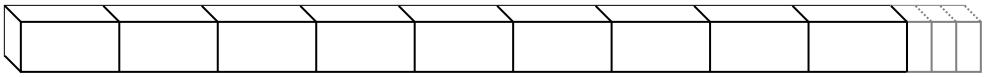

Antworten

Bsp. 17

1. _____
2. _____
3. _____
4. _____
5. _____
6. _____
7. _____
8. _____
9. _____
10. _____

1-10	90	80	70	60	50	40	30	20	10	0

Kleinere Einheiten identifizieren

Name: **Lösungsschlüssel**

Bestimme die Anzahl der kleinen Teilstücke, die aus dem größeren Stück gemacht werden können.

Bsp) $5\frac{2}{3}$

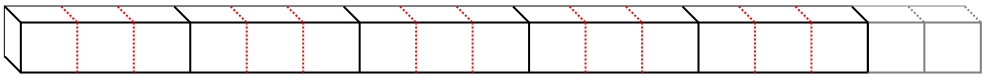

1) $3\frac{3}{4}$

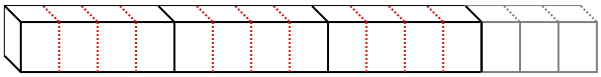

2) $9\frac{1}{5}$

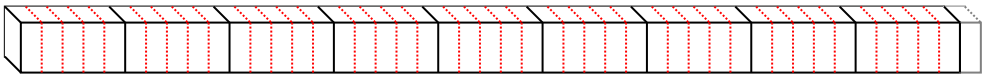

3) $1\frac{2}{3}$



4) $6\frac{1}{3}$

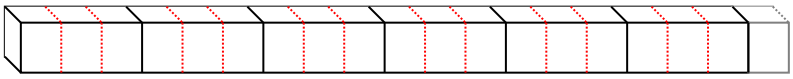

5) $1\frac{1}{4}$



6) $1\frac{4}{5}$

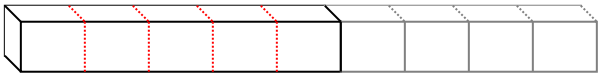

7) $9\frac{2}{5}$

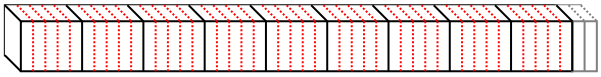

8) $8\frac{1}{2}$

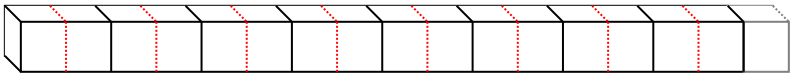

9) $9\frac{1}{2}$

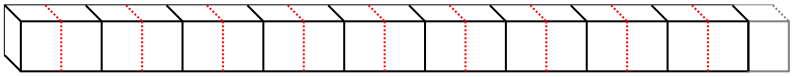

10) $9\frac{3}{4}$

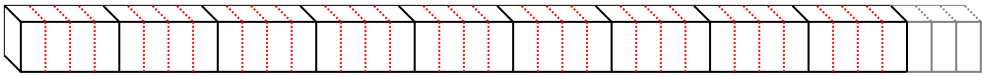

Antworten

Bsp.	17
1.	15
2.	46
3.	5
4.	19
5.	5
6.	9
7.	47
8.	17
9.	19
10.	39