Finden von Winkeln in Formen

Name:

Zähle die Anzahl von spitzwinkligen, stumpfwinkligen, rechtwinkligen und überstumpften Winkeln in jeder Form.

Bsp)

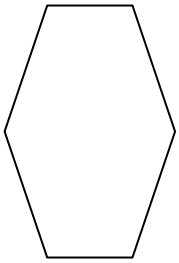

1)

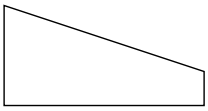

2)



3)



4)

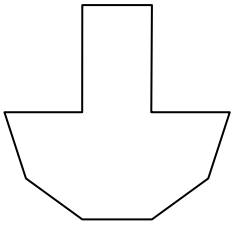

5)

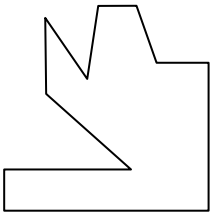

6)



7)

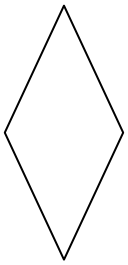

8)

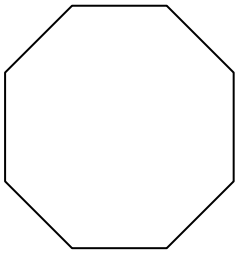

9)

10)

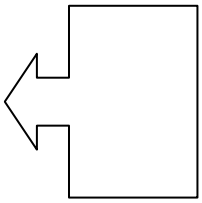

11)

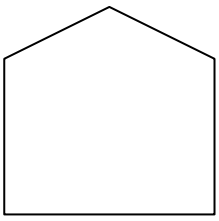

Antworten

Bsp.	0	0	6	0
1.				
2.				
3.				
4.				
5.				
6.				
7.				
8.				
9.				
10.				
11.				

Finden von Winkeln in Formen

Name: **Lösungsschlüssel**

Zähle die Anzahl von spitzwinkligen, stumpfwinkligen, rechtwinkligen und überstumpften Winkeln in jeder Form.

Bsp)

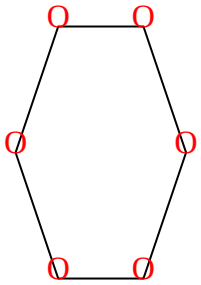

1)

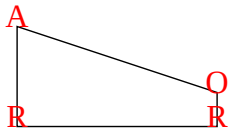

2)

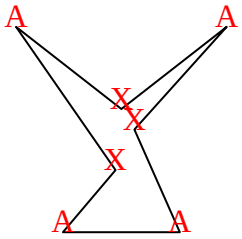

3)

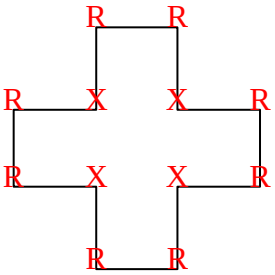

4)

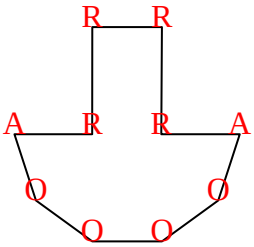

5)

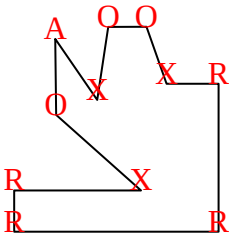

6)

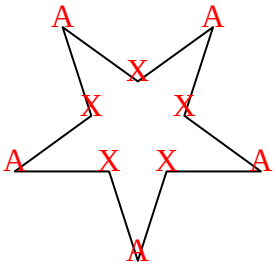

7)

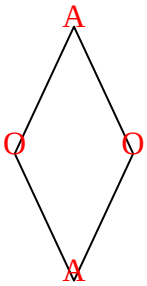

8)

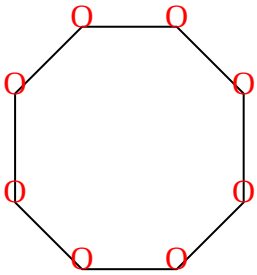

9)



10)

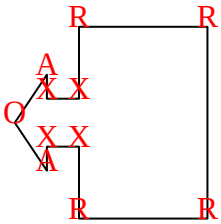

11)

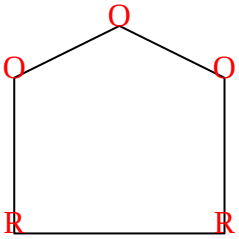

Antworten

Bsp.	0	0	6	0
1.	1	1	2	0
2.	4	0	0	3
3.	0	0	8	4
4.	2	4	4	0
5.	1	3	4	3
6.	5	0	0	5
7.	2	2	0	0
8.	0	8	0	0
9.	0	0	4	0
10.	2	1	4	4
11.	0	3	2	0