# Finden von Winkeln in Formen

Name:

**Zähle die Anzahl von spitzwinkligen, stumpfwinkligen, rechtwinkligen und überstumpften Winkeln in jeder Form.**

**Bsp)**

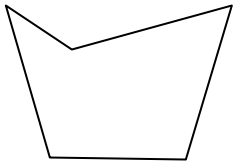

**1)**



**2)**

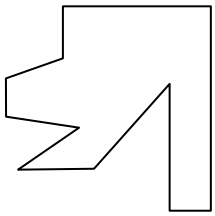

**3)**

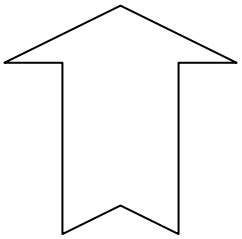

**4)**

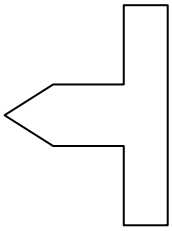

**5)**

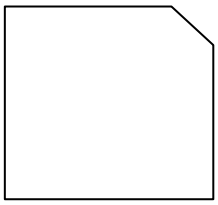

**6)**

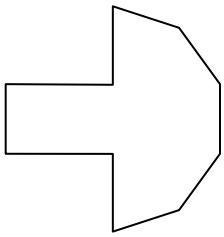

**7)**

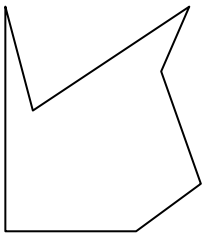

**8)**

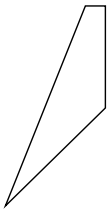

**9)**



**10)**



**11)**

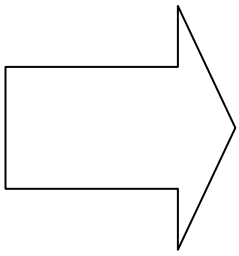

## Antworten

| | | | | |
|---|---|---|---|---|
| Bsp. | 2 | 2 | 0 | 1 |
| 1. | | | | |
| 2. | | | | |
| 3. | | | | |
| 4. | | | | |
| 5. | | | | |
| 6. | | | | |
| 7. | | | | |
| 8. | | | | |
| 9. | | | | |
| 10. | | | | |
| 11. | | | | |



| | | | | | | | | | | |
|---|---|---|---|---|---|---|---|---|---|---|
| 1-10 | 91 | 82 | 73 | 64 | 55 | 45 | 36 | 27 | 18 | 9 |
| 11 | 0 | | | | | | | | | |

Finden von Winkeln in Formen

Name: **Lösungsschlüssel**

**Zähle die Anzahl von spitzwinkligen, stumpfwinkligen, rechtwinkligen und überstumpften Winkeln in jeder Form.**

**Bsp)**

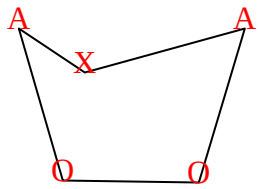


**1)**

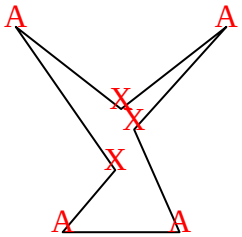


**2)**

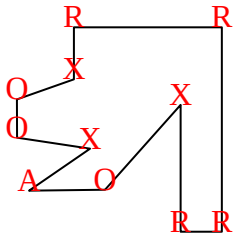


**3)**

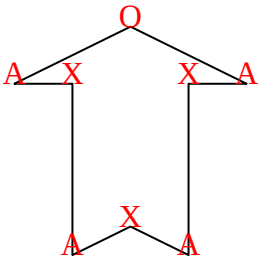


**4)**

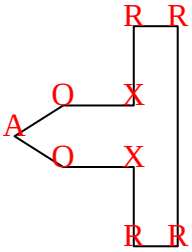


**5)**

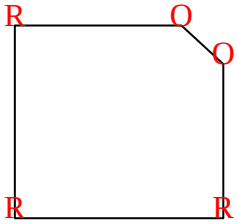


**6)**

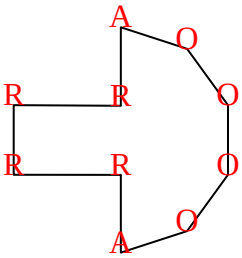


**7)**

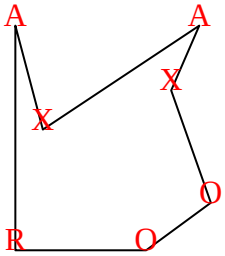


**8)**

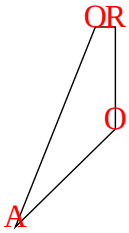


**9)**

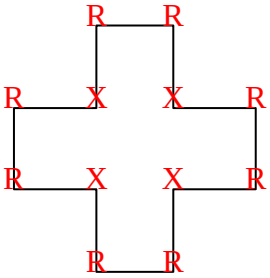


**10)**

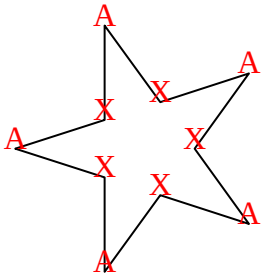


**11)**

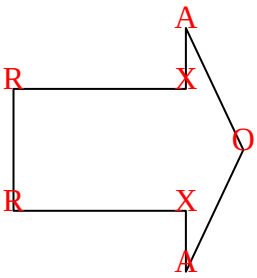


## Antworten

| | | | | |
|---|---|---|---|---|
| Bsp. | 2 | 2 | 0 | 1 |
| 1. | 4 | 0 | 0 | 3 |
| 2. | 1 | 3 | 4 | 3 |
| 3. | 4 | 1 | 0 | 3 |
| 4. | 1 | 2 | 4 | 2 |
| 5. | 0 | 2 | 3 | 0 |
| 6. | 2 | 4 | 4 | 0 |
| 7. | 2 | 2 | 1 | 2 |
| 8. | 1 | 2 | 1 | 0 |
| 9. | 0 | 0 | 8 | 4 |
| 10. | 5 | 0 | 0 | 5 |
| 11. | 2 | 1 | 2 | 2 |



| | | | | | | | | | | |
|---|---|---|---|---|---|---|---|---|---|---|
| 1-10 | 91 | 82 | 73 | 64 | 55 | 45 | 36 | 27 | 18 | 9 |
| 11 | 0 | | | | | | | | | |

Finden von Winkeln in Formen

Name:

**Zähle die Anzahl von spitzwinkligen, stumpfwinkligen, rechtwinkligen und überstumpften Winkeln in jeder Form.**

**Bsp)**



**1)**

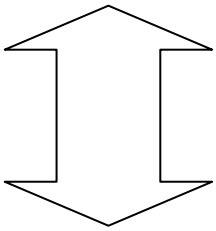

**2)**

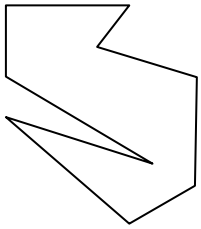

**3)**

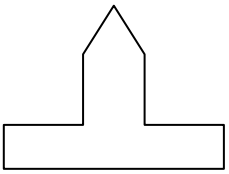

**4)**



**5)**

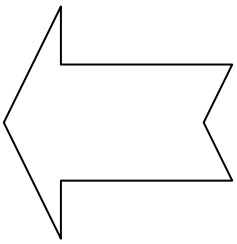

**6)**

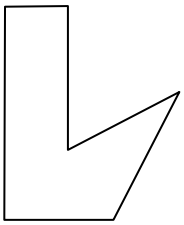

**7)**

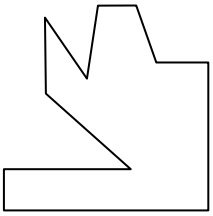

**8)**

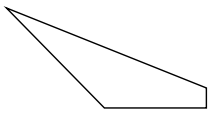

**9)**

**10)**

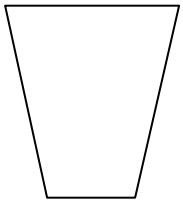

**11)**

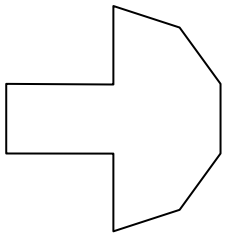

## Antworten

| | | | | |
|---|---|---|---|---|
| Bsp. | 5 | 0 | 0 | 5 |
| 1. | | | | |
| 2. | | | | |
| 3. | | | | |
| 4. | | | | |
| 5. | | | | |
| 6. | | | | |
| 7. | | | | |
| 8. | | | | |
| 9. | | | | |
| 10. | | | | |
| 11. | | | | |



| | | | | | | | | | | |
|---|---|---|---|---|---|---|---|---|---|---|
| 1-10 | 91 | 82 | 73 | 64 | 55 | 45 | 36 | 27 | 18 | 9 |
| 11 | 0 | | | | | | | | | |

**Zähle die Anzahl von spitzwinkligen, stumpfwinkligen, rechtwinkligen und überstumpften Winkeln in jeder Form.**

**Bsp)**

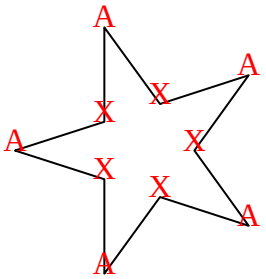


**1)**

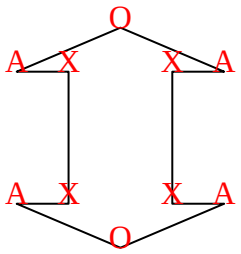


**2)**

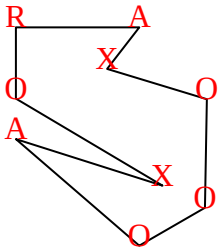


**3)**

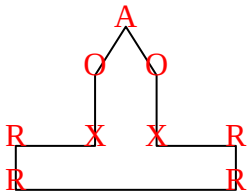


**4)**

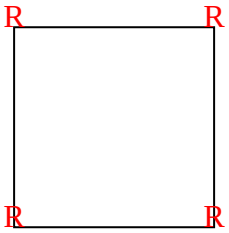


**5)**

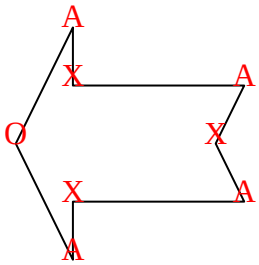


**6)**

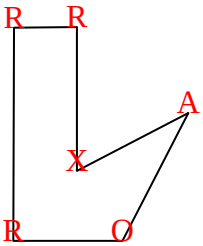


**7)**

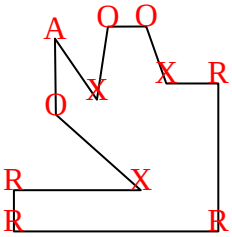


**8)**

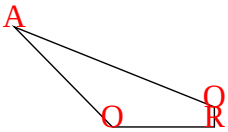


**9)**




**10)**

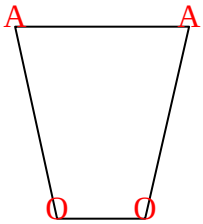


**11)**

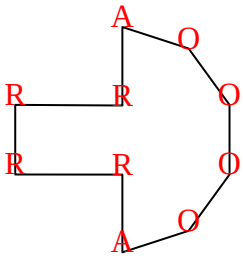


## Antworten

| | | | | |
|---|---|---|---|---|
| Bsp. | 5 | 0 | 0 | 5 |
| 1. | 4 | 2 | 0 | 4 |
| 2. | 2 | 4 | 1 | 2 |
| 3. | 1 | 2 | 4 | 2 |
| 4. | 0 | 0 | 4 | 0 |
| 5. | 4 | 1 | 0 | 3 |
| 6. | 1 | 1 | 3 | 1 |
| 7. | 1 | 3 | 4 | 3 |
| 8. | 1 | 2 | 1 | 0 |
| 9. | 0 | 0 | 4 | 0 |
| 10. | 2 | 2 | 0 | 0 |
| 11. | 2 | 4 | 4 | 0 |



| | | | | | | | | | | |
|---|---|---|---|---|---|---|---|---|---|---|
| 1-10 | 91 | 82 | 73 | 64 | 55 | 45 | 36 | 27 | 18 | 9 |
| 11 | 0 | | | | | | | | | |

Finden von Winkeln in Formen

Name:

**Zähle die Anzahl von spitzwinkligen, stumpfwinkligen, rechtwinkligen und überstumpften Winkeln in jeder Form.**

**Bsp)**

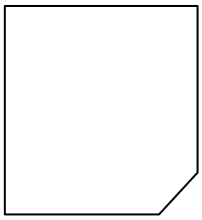

**1)**

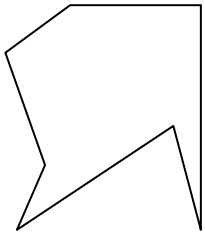

**2)**



**3)**

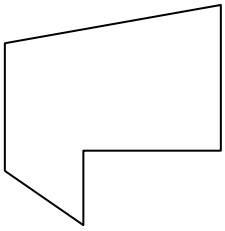

**4)**

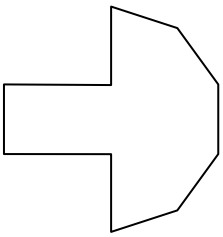

**5)**

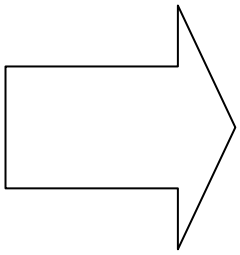

**6)**

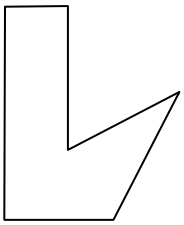

**7)**

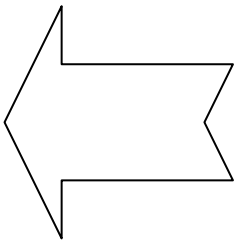

**8)**

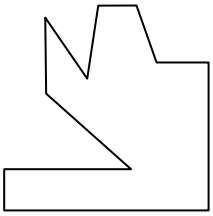

**9)**

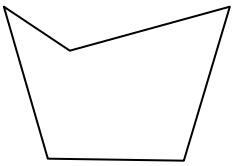

**10)**



**11)**



## Antworten

| | | | | |
|---|---|---|---|---|
| Bsp. | 0 | 2 | 3 | 0 |
| 1. | | | | |
| 2. | | | | |
| 3. | | | | |
| 4. | | | | |
| 5. | | | | |
| 6. | | | | |
| 7. | | | | |
| 8. | | | | |
| 9. | | | | |
| 10. | | | | |
| 11. | | | | |



| | | | | | | | | | | |
|---|---|---|---|---|---|---|---|---|---|---|
| 1-10 | 91 | 82 | 73 | 64 | 55 | 45 | 36 | 27 | 18 | 9 |
| 11 | 0 | | | | | | | | | |

Finden von Winkeln in Formen

Name: **Lösungsschlüssel**

**Zähle die Anzahl von spitzwinkligen, stumpfwinkligen, rechtwinkligen und überstumpften Winkeln in jeder Form.**

**Bsp)**

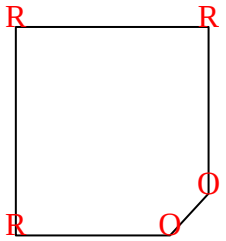


**1)**

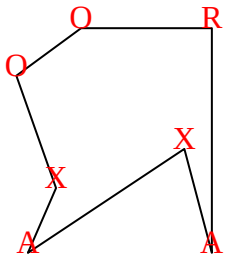


**2)**




**3)**

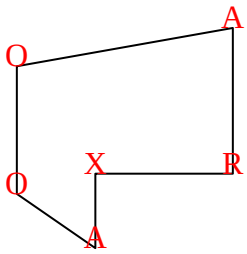


**4)**

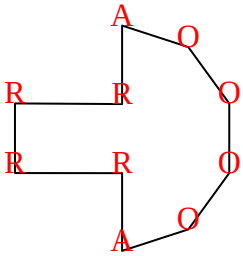


**5)**

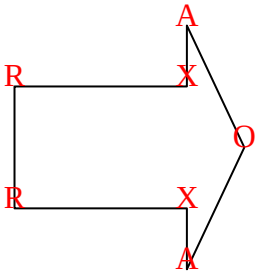


**6)**

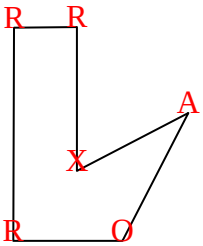


**7)**

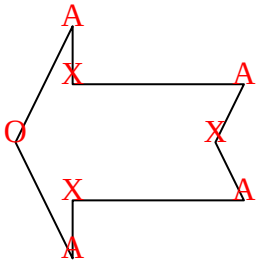


**8)**

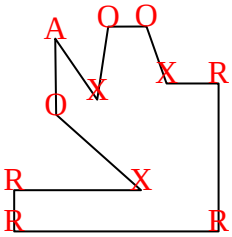


**9)**

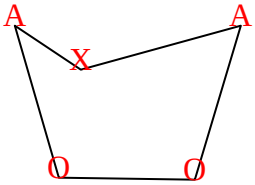


**10)**

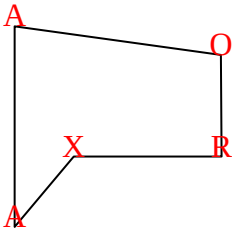


**11)**

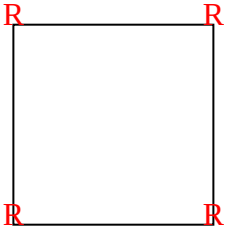


## Antworten

| | | | | |
|---|---|---|---|---|
| Bsp. | 0 | 2 | 3 | 0 |
| 1. | 2 | 2 | 1 | 2 |
| 2. | 0 | 0 | 4 | 0 |
| 3. | 2 | 2 | 1 | 1 |
| 4. | 2 | 4 | 4 | 0 |
| 5. | 2 | 1 | 2 | 2 |
| 6. | 1 | 1 | 3 | 1 |
| 7. | 4 | 1 | 0 | 3 |
| 8. | 1 | 3 | 4 | 3 |
| 9. | 2 | 2 | 0 | 1 |
| 10. | 2 | 1 | 1 | 1 |
| 11. | 0 | 0 | 4 | 0 |



| | | | | | | | | | | |
|---|---|---|---|---|---|---|---|---|---|---|
| 1-10 | 91 | 82 | 73 | 64 | 55 | 45 | 36 | 27 | 18 | 9 |
| 11 | 0 | | | | | | | | | |

Finden von Winkeln in Formen

Name:

**Zähle die Anzahl von spitzwinkligen, stumpfwinkligen, rechtwinkligen und überstumpften Winkeln in jeder Form.**

**Bsp)**

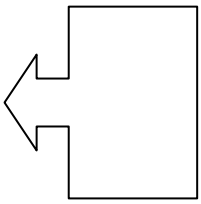

**1)**

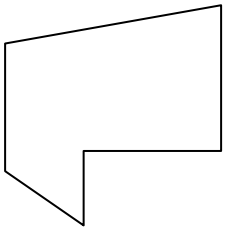

**2)**

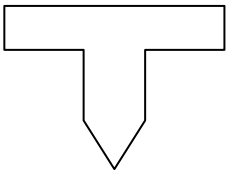

**3)**

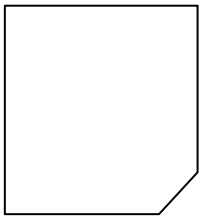

**4)**

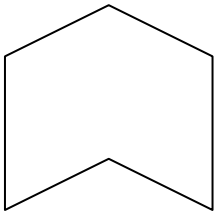

**5)**

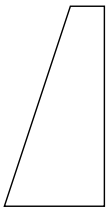

**6)**

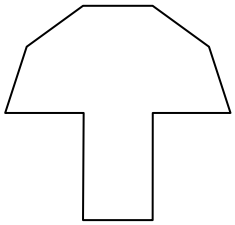

**7)**

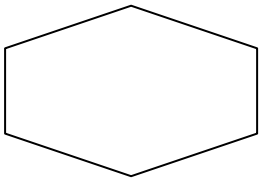

**8)**

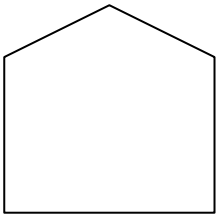

**9)**

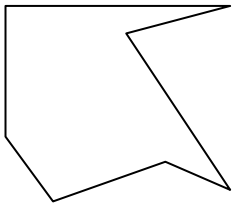

**10)**

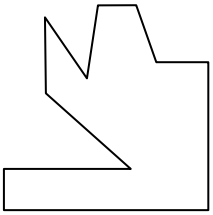

**11)**

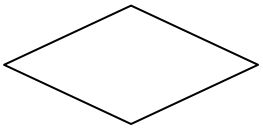

## Antworten

| | | | | |
|---|---|---|---|---|
| Bsp. | 2 | 1 | 4 | 4 |
| 1. | | | | |
| 2. | | | | |
| 3. | | | | |
| 4. | | | | |
| 5. | | | | |
| 6. | | | | |
| 7. | | | | |
| 8. | | | | |
| 9. | | | | |
| 10. | | | | |
| 11. | | | | |



| | | | | | | | | | | |
|---|---|---|---|---|---|---|---|---|---|---|
| 1-10 | 91 | 82 | 73 | 64 | 55 | 45 | 36 | 27 | 18 | 9 |
| 11 | 0 | | | | | | | | | |

Finden von Winkeln in Formen

Name: **Lösungsschlüssel**

**Zähle die Anzahl von spitzwinkligen, stumpfwinkligen, rechtwinkligen und überstumpften Winkeln in jeder Form.**

**Bsp)**

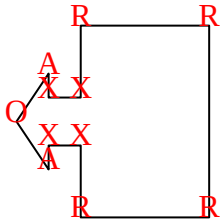


**1)**

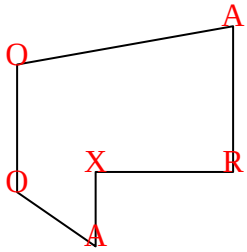


**2)**

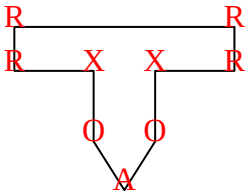


**3)**

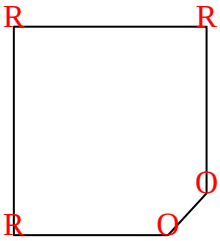


**4)**

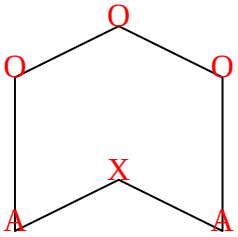


**5)**

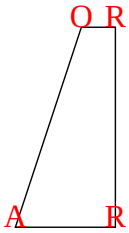


**6)**

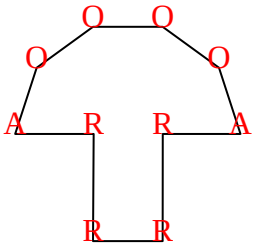


**7)**

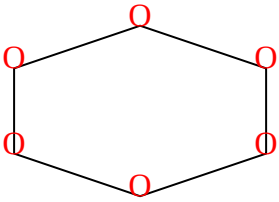


**8)**

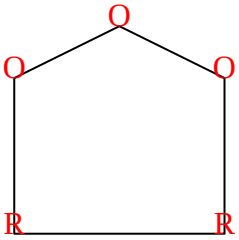


**9)**

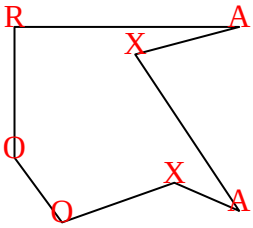


**10)**

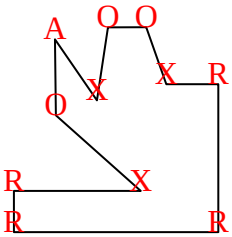


**11)**

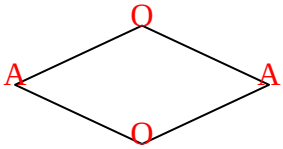


## Antworten

| | | | | |
|---|---|---|---|---|
| Bsp. | 2 | 1 | 4 | 4 |
| 1. | 2 | 2 | 1 | 1 |
| 2. | 1 | 2 | 4 | 2 |
| 3. | 0 | 2 | 3 | 0 |
| 4. | 2 | 3 | 0 | 1 |
| 5. | 1 | 1 | 2 | 0 |
| 6. | 2 | 4 | 4 | 0 |
| 7. | 0 | 0 | 6 | 0 |
| 8. | 0 | 3 | 2 | 0 |
| 9. | 2 | 2 | 1 | 2 |
| 10. | 1 | 3 | 4 | 3 |
| 11. | 2 | 2 | 0 | 0 |



| | | | | | | | | | | |
|---|---|---|---|---|---|---|---|---|---|---|
| 1-10 | 91 | 82 | 73 | 64 | 55 | 45 | 36 | 27 | 18 | 9 |
| 11 | 0 | | | | | | | | | |

Finden von Winkeln in Formen

Name:

**Zähle die Anzahl von spitzwinkligen, stumpfwinkligen, rechtwinkligen und überstumpften Winkeln in jeder Form.**

**Bsp)**



**1)**

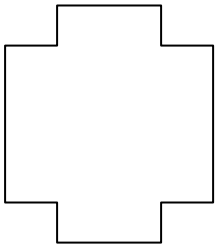

**2)**

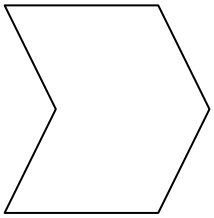

**3)**

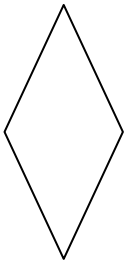

**4)**

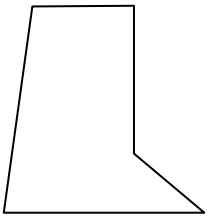

**5)**

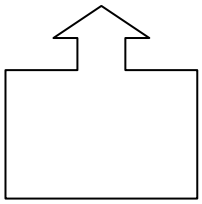

**6)**



**7)**

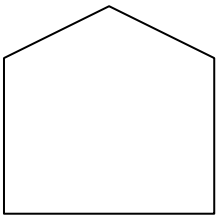

**8)**

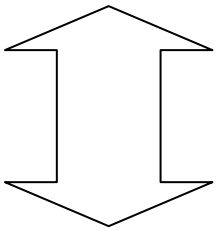

**9)**

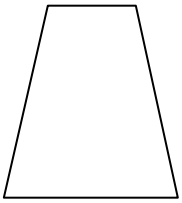

**10)**



**11)**

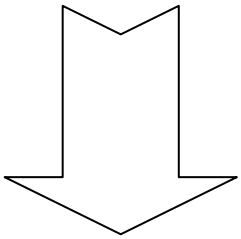

## Antworten

| | | | | |
|---|---|---|---|---|
| Bsp. | 4 | 0 | 0 | 3 |
| 1. | | | | |
| 2. | | | | |
| 3. | | | | |
| 4. | | | | |
| 5. | | | | |
| 6. | | | | |
| 7. | | | | |
| 8. | | | | |
| 9. | | | | |
| 10. | | | | |
| 11. | | | | |



| | | | | | | | | | | |
|---|---|---|---|---|---|---|---|---|---|---|
| 1-10 | 91 | 82 | 73 | 64 | 55 | 45 | 36 | 27 | 18 | 9 |
| 11 | 0 | | | | | | | | | |

Finden von Winkeln in Formen

Name: **Lösungsschlüssel**

**Zähle die Anzahl von spitzwinkligen, stumpfwinkligen, rechtwinkligen und überstumpften Winkeln in jeder Form.**

**Bsp)**

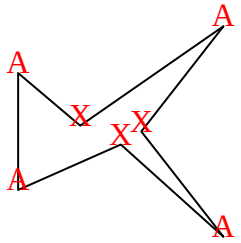


**1)**

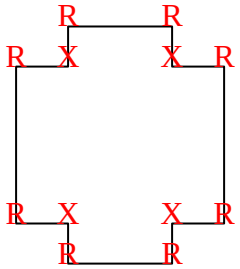


**2)**

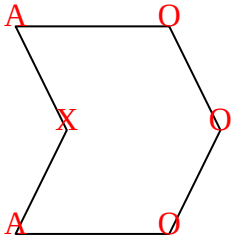


**3)**

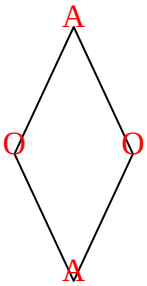


**4)**

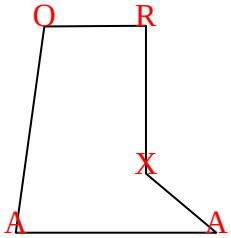


**5)**

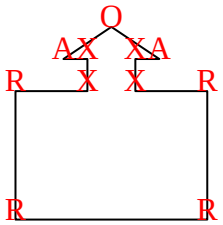


**6)**

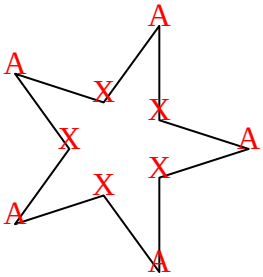


**7)**

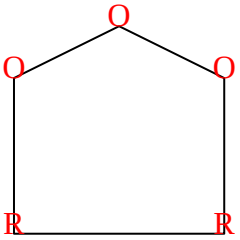


**8)**

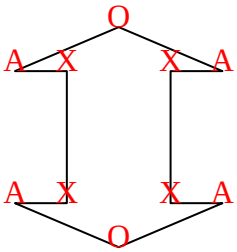


**9)**

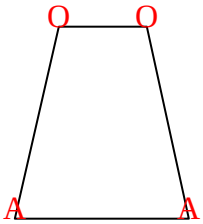


**10)**

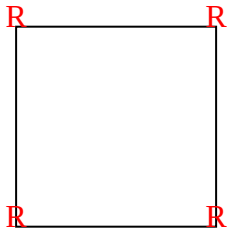


**11)**

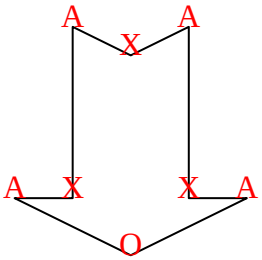


## Antworten

| | | | | |
|---|---|---|---|---|
| Bsp. | 4 | 0 | 0 | 3 |
| 1. | 0 | 0 | 8 | 4 |
| 2. | 2 | 3 | 0 | 1 |
| 3. | 2 | 2 | 0 | 0 |
| 4. | 2 | 1 | 1 | 1 |
| 5. | 2 | 1 | 4 | 4 |
| 6. | 5 | 0 | 0 | 5 |
| 7. | 0 | 3 | 2 | 0 |
| 8. | 4 | 2 | 0 | 4 |
| 9. | 2 | 2 | 0 | 0 |
| 10. | 0 | 0 | 4 | 0 |
| 11. | 4 | 1 | 0 | 3 |



| | | | | | | | | | | |
|---|---|---|---|---|---|---|---|---|---|---|
| 1-10 | 91 | 82 | 73 | 64 | 55 | 45 | 36 | 27 | 18 | 9 |
| 11 | 0 | | | | | | | | | |

Finden von Winkeln in Formen

Name:

**Zähle die Anzahl von spitzwinkligen, stumpfwinkligen, rechtwinkligen und überstumpften Winkeln in jeder Form.**

**Bsp)**

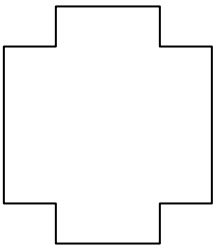

**1)**

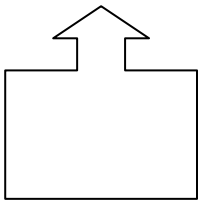

**2)**

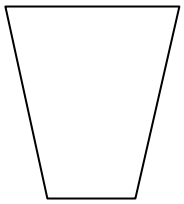

**3)**

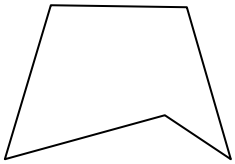

**4)**

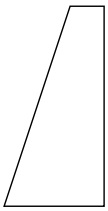

**5)**

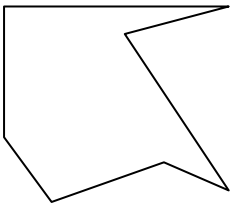

**6)**

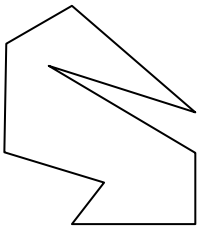

**7)**



**8)**



**9)**

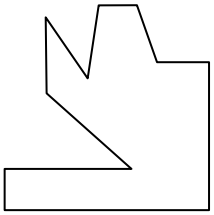

**10)**

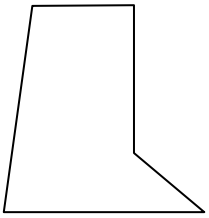

**11)**

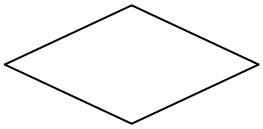

## Antworten

| | | | | |
|---|---|---|---|---|
| Bsp. | 0 | 0 | 8 | 4 |
| 1. | | | | |
| 2. | | | | |
| 3. | | | | |
| 4. | | | | |
| 5. | | | | |
| 6. | | | | |
| 7. | | | | |
| 8. | | | | |
| 9. | | | | |
| 10. | | | | |
| 11. | | | | |



| | | | | | | | | | | |
|---|---|---|---|---|---|---|---|---|---|---|
| 1-10 | 91 | 82 | 73 | 64 | 55 | 45 | 36 | 27 | 18 | 9 |
| 11 | 0 | | | | | | | | | |

Finden von Winkeln in Formen

Name: **Lösungsschlüssel**

**Zähle die Anzahl von spitzwinkligen, stumpfwinkligen, rechtwinkligen und überstumpften Winkeln in jeder Form.**

**Bsp)**

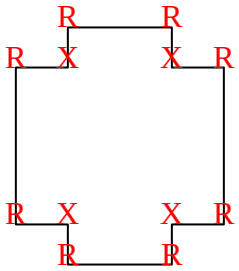


**1)**

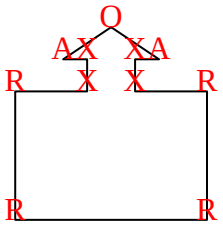


**2)**

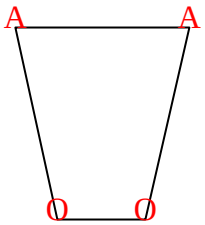


**3)**

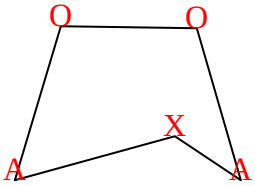


**4)**

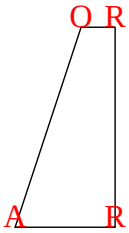


**5)**

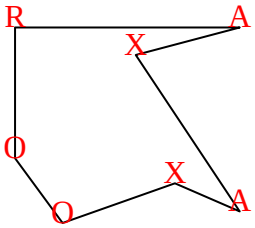


**6)**

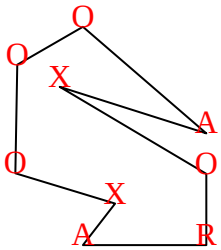


**7)**

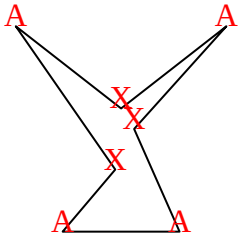


**8)**




**9)**

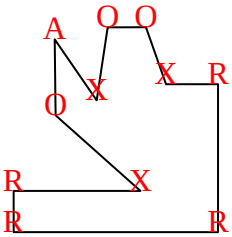


**10)**

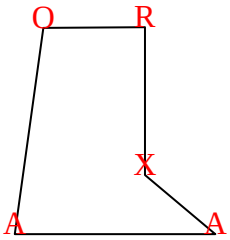


**11)**

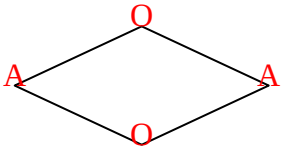


## Antworten

| | | | | |
|---|---|---|---|---|
| Bsp. | 0 | 0 | 8 | 4 |
| 1. | 2 | 1 | 4 | 4 |
| 2. | 2 | 2 | 0 | 0 |
| 3. | 2 | 2 | 0 | 1 |
| 4. | 1 | 1 | 2 | 0 |
| 5. | 2 | 2 | 1 | 2 |
| 6. | 2 | 4 | 1 | 2 |
| 7. | 4 | 0 | 0 | 3 |
| 8. | 0 | 0 | 4 | 0 |
| 9. | 1 | 3 | 4 | 3 |
| 10. | 2 | 1 | 1 | 1 |
| 11. | 2 | 2 | 0 | 0 |



| | | | | | | | | | | |
|---|---|---|---|---|---|---|---|---|---|---|
| 1-10 | 91 | 82 | 73 | 64 | 55 | 45 | 36 | 27 | 18 | 9 |
| 11 | 0 | | | | | | | | | |

Finden von Winkeln in Formen

Name:

**Zähle die Anzahl von spitzwinkligen, stumpfwinkligen, rechtwinkligen und überstumpften Winkeln in jeder Form.**

**Bsp)**

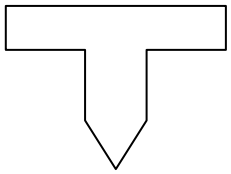

**1)**

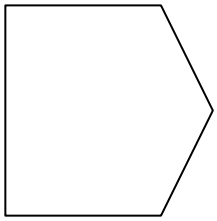

**2)**

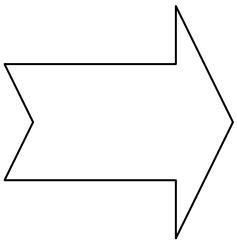

**3)**

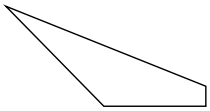

**4)**

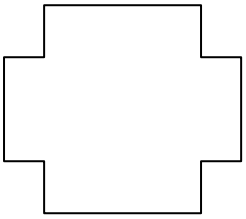

**5)**

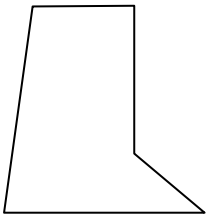

**6)**



**7)**



**8)**

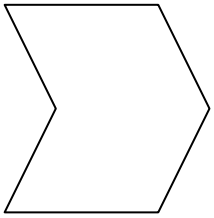

**9)**

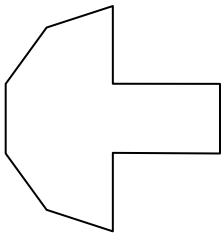

**10)**

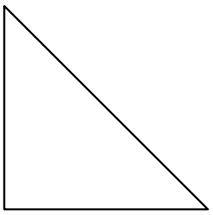

**11)**

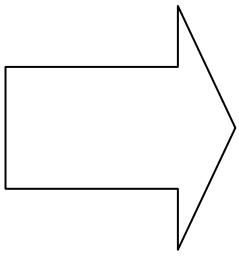

## Antworten

| | | | | |
|---|---|---|---|---|
| Bsp. | 1 | 2 | 4 | 2 |
| 1. | | | | |
| 2. | | | | |
| 3. | | | | |
| 4. | | | | |
| 5. | | | | |
| 6. | | | | |
| 7. | | | | |
| 8. | | | | |
| 9. | | | | |
| 10. | | | | |
| 11. | | | | |



| | | | | | | | | | | |
|---|---|---|---|---|---|---|---|---|---|---|
| 1-10 | 91 | 82 | 73 | 64 | 55 | 45 | 36 | 27 | 18 | 9 |
| 11 | 0 | | | | | | | | | |

Finden von Winkeln in Formen

Name: **Lösungsschlüssel**

**Zähle die Anzahl von spitzwinkligen, stumpfwinkligen, rechtwinkligen und überstumpften Winkeln in jeder Form.**

**Bsp)**

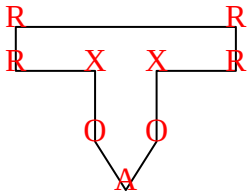


**1)**

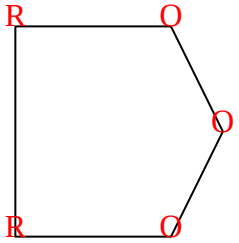


**2)**

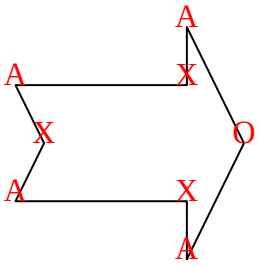


**3)**

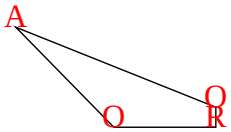


**4)**

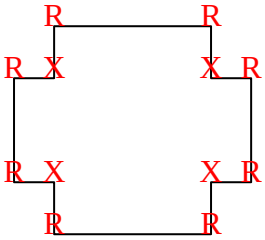


**5)**

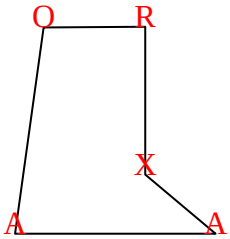


**6)**

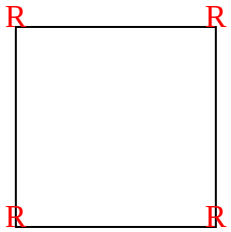


**7)**




**8)**

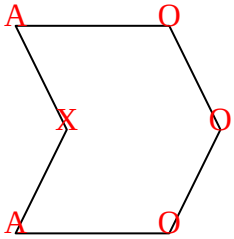


**9)**

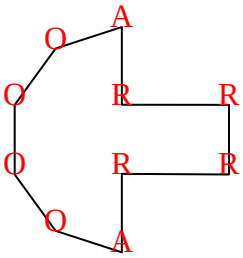


**10)**

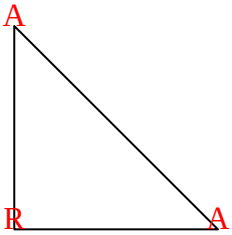


**11)**

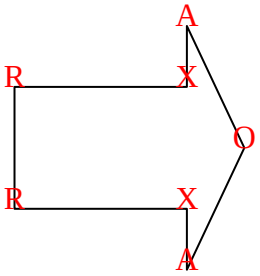


## Antworten

| | | | | |
|---|---|---|---|---|
| Bsp. | 1 | 2 | 4 | 2 |
| 1. | 0 | 3 | 2 | 0 |
| 2. | 4 | 1 | 0 | 3 |
| 3. | 1 | 2 | 1 | 0 |
| 4. | 0 | 0 | 8 | 4 |
| 5. | 2 | 1 | 1 | 1 |
| 6. | 0 | 0 | 4 | 0 |
| 7. | 0 | 0 | 4 | 0 |
| 8. | 2 | 3 | 0 | 1 |
| 9. | 2 | 4 | 4 | 0 |
| 10. | 2 | 0 | 1 | 0 |
| 11. | 2 | 1 | 2 | 2 |



| | | | | | | | | | | |
|---|---|---|---|---|---|---|---|---|---|---|
| 1-10 | 91 | 82 | 73 | 64 | 55 | 45 | 36 | 27 | 18 | 9 |
| 11 | 0 | | | | | | | | | |

Finden von Winkeln in Formen

Name:

**Zähle die Anzahl von spitzwinkligen, stumpfwinkligen, rechtwinkligen und überstumpften Winkeln in jeder Form.**

**Bsp)**



**1)**

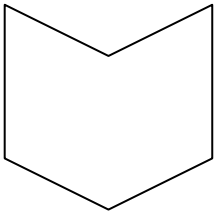

**2)**

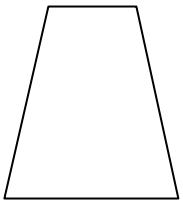

**3)**



**4)**

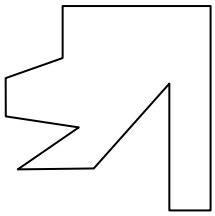

**5)**

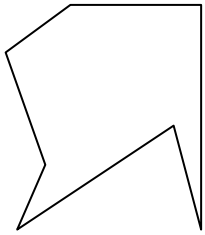

**6)**

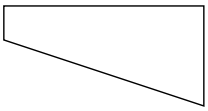

**7)**

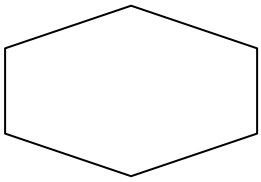

**8)**

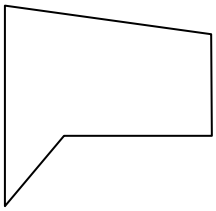

**9)**

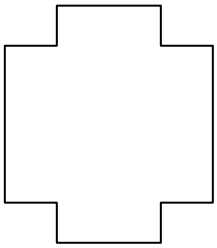

**10)**

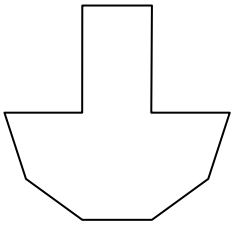

**11)**

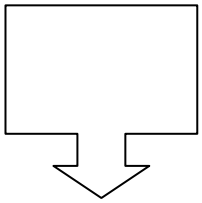

## Antworten

| | | | | |
|---|---|---|---|---|
| Bsp. | 2 | 2 | 1 | 1 |
| 1. | | | | |
| 2. | | | | |
| 3. | | | | |
| 4. | | | | |
| 5. | | | | |
| 6. | | | | |
| 7. | | | | |
| 8. | | | | |
| 9. | | | | |
| 10. | | | | |
| 11. | | | | |



| | | | | | | | | | | |
|---|---|---|---|---|---|---|---|---|---|---|
| 1-10 | 91 | 82 | 73 | 64 | 55 | 45 | 36 | 27 | 18 | 9 |
| 11 | 0 | | | | | | | | | |

Finden von Winkeln in Formen

Name: **Lösungsschlüssel**

**Zähle die Anzahl von spitzwinkligen, stumpfwinkligen, rechtwinkligen und überstumpften Winkeln in jeder Form.**

**Bsp)**

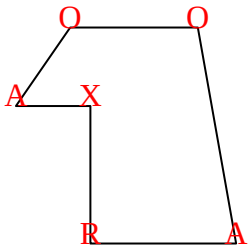


**1)**

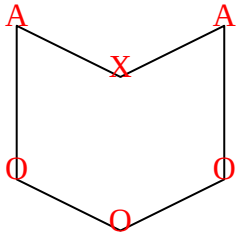


**2)**

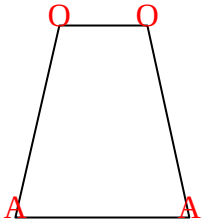


**3)**

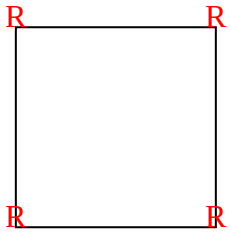


**4)**

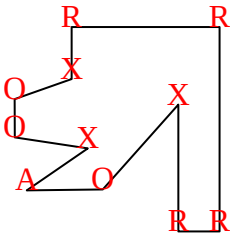


**5)**

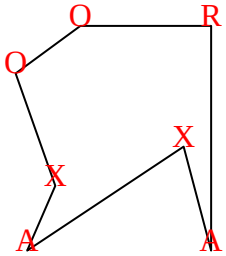


**6)**

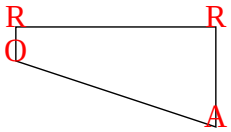


**7)**

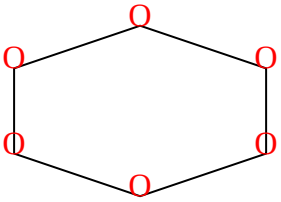


**8)**

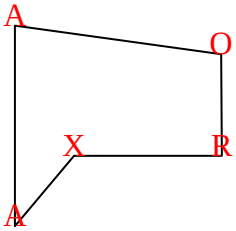


**9)**

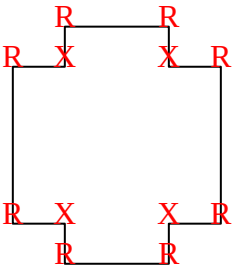


**10)**

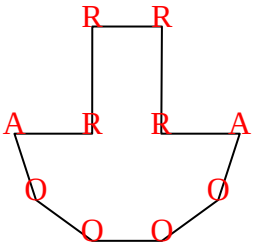


**11)**

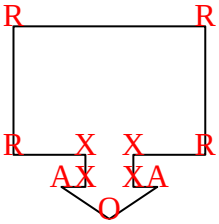


## Antworten

| | | | | |
|---|---|---|---|---|
| Bsp. | 2 | 2 | 1 | 1 |
| 1. | 2 | 3 | 0 | 1 |
| 2. | 2 | 2 | 0 | 0 |
| 3. | 0 | 0 | 4 | 0 |
| 4. | 1 | 3 | 4 | 3 |
| 5. | 2 | 2 | 1 | 2 |
| 6. | 1 | 1 | 2 | 0 |
| 7. | 0 | 0 | 6 | 0 |
| 8. | 2 | 1 | 1 | 1 |
| 9. | 0 | 0 | 8 | 4 |
| 10. | 2 | 4 | 4 | 0 |
| 11. | 2 | 1 | 4 | 4 |



| | | | | | | | | | | |
|---|---|---|---|---|---|---|---|---|---|---|
| 1-10 | 91 | 82 | 73 | 64 | 55 | 45 | 36 | 27 | 18 | 9 |
| 11 | 0 | | | | | | | | | |

Finden von Winkeln in Formen

Name:

**Zähle die Anzahl von spitzwinkligen, stumpfwinkligen, rechtwinkligen und überstumpften Winkeln in jeder Form.**

**Bsp)**



**1)**

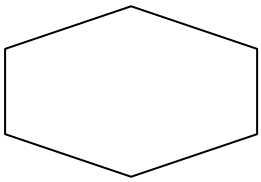

**2)**

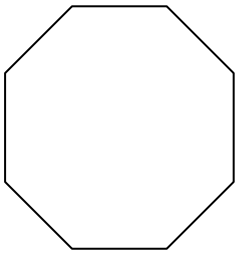

**3)**

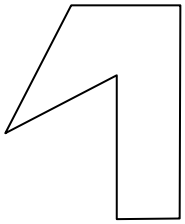

**4)**

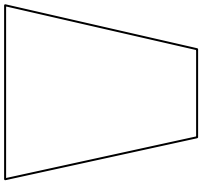

**5)**



**6)**



**7)**

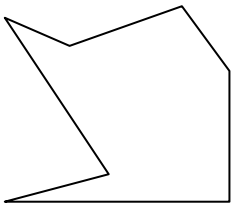

**8)**

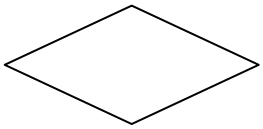

**9)**

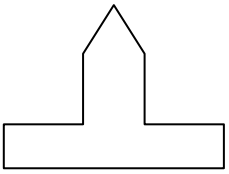

**10)**

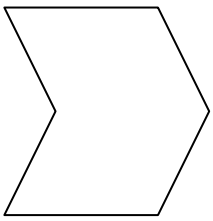

**11)**

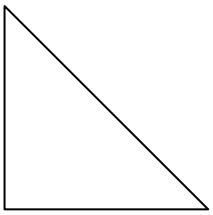

## Antworten

| | | | | |
|---|---|---|---|---|
| Bsp. | 4 | 0 | 0 | 3 |
| 1. | | | | |
| 2. | | | | |
| 3. | | | | |
| 4. | | | | |
| 5. | | | | |
| 6. | | | | |
| 7. | | | | |
| 8. | | | | |
| 9. | | | | |
| 10. | | | | |
| 11. | | | | |



| | | | | | | | | | | |
|---|---|---|---|---|---|---|---|---|---|---|
| 1-10 | 91 | 82 | 73 | 64 | 55 | 45 | 36 | 27 | 18 | 9 |
| 11 | 0 | | | | | | | | | |

Finden von Winkeln in Formen

Name: **Lösungsschlüssel**

**Zähle die Anzahl von spitzwinkligen, stumpfwinkligen, rechtwinkligen und überstumpften Winkeln in jeder Form.**

**Bsp)**

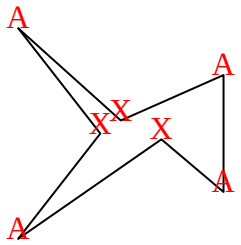


**1)**

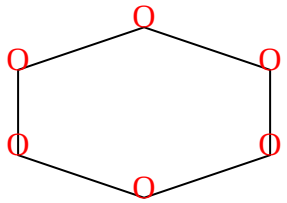


**2)**

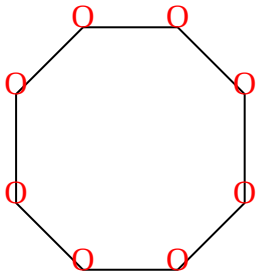


**3)**

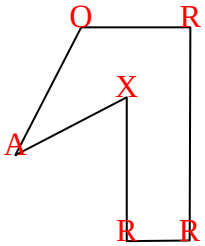


**4)**

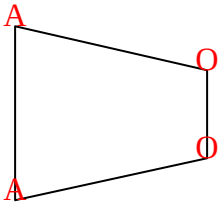


**5)**

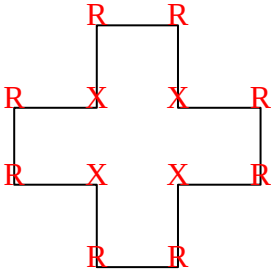


**6)**

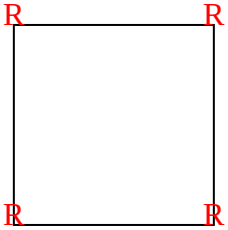


**7)**

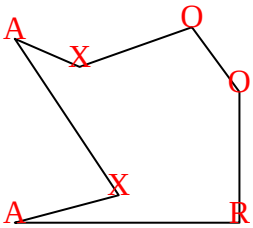


**8)**

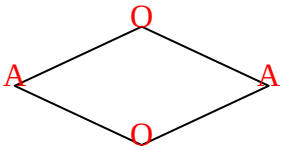


**9)**

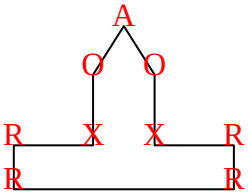


**10)**

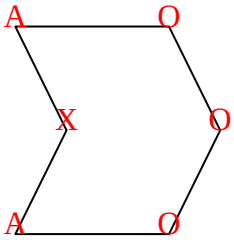


**11)**

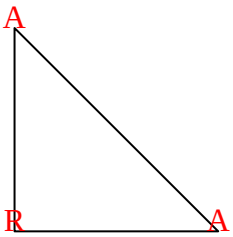


## Antworten

| | | | | |
|---|---|---|---|---|
| Bsp. | 4 | 0 | 0 | 3 |
| 1. | 0 | 0 | 6 | 0 |
| 2. | 0 | 8 | 0 | 0 |
| 3. | 1 | 1 | 3 | 1 |
| 4. | 2 | 2 | 0 | 0 |
| 5. | 0 | 0 | 8 | 4 |
| 6. | 0 | 0 | 4 | 0 |
| 7. | 2 | 2 | 1 | 2 |
| 8. | 2 | 2 | 0 | 0 |
| 9. | 1 | 2 | 4 | 2 |
| 10. | 2 | 3 | 0 | 1 |
| 11. | 2 | 0 | 1 | 0 |



| | | | | | | | | | | |
|---|---|---|---|---|---|---|---|---|---|---|
| 1-10 | 91 | 82 | 73 | 64 | 55 | 45 | 36 | 27 | 18 | 9 |
| 11 | 0 | | | | | | | | | |

Finden von Winkeln in Formen

Name:

**Zähle die Anzahl von spitzwinkligen, stumpfwinkligen, rechtwinkligen und überstumpften Winkeln in jeder Form.**

**Bsp)**

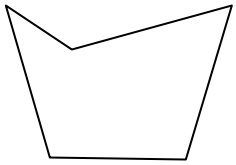

**1)**

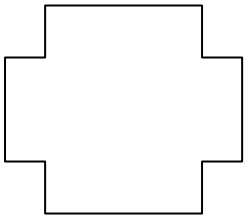

**2)**

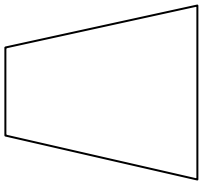

**3)**

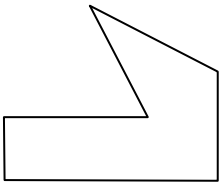

**4)**

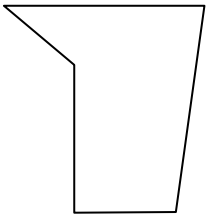

**5)**



**6)**

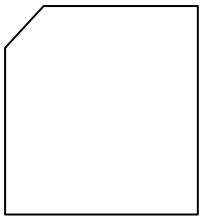

**7)**

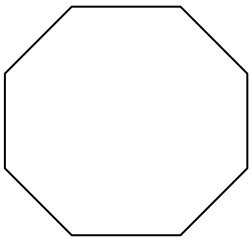

**8)**



**9)**

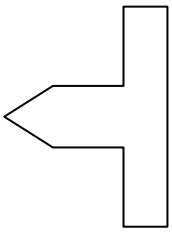

**10)**

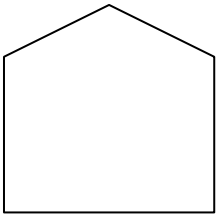

**11)**

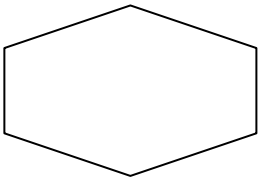

## Antworten

| | | | | |
|---|---|---|---|---|
| Bsp. | 2 | 2 | 0 | 1 |
| 1. | | | | |
| 2. | | | | |
| 3. | | | | |
| 4. | | | | |
| 5. | | | | |
| 6. | | | | |
| 7. | | | | |
| 8. | | | | |
| 9. | | | | |
| 10. | | | | |
| 11. | | | | |



| | | | | | | | | | | |
|---|---|---|---|---|---|---|---|---|---|---|
| 1-10 | 91 | 82 | 73 | 64 | 55 | 45 | 36 | 27 | 18 | 9 |
| 11 | 0 | | | | | | | | | |

Finden von Winkeln in Formen

Name: **Lösungsschlüssel**

**Zähle die Anzahl von spitzwinkligen, stumpfwinkligen, rechtwinkligen und überstumpften Winkeln in jeder Form.**

**Bsp)**

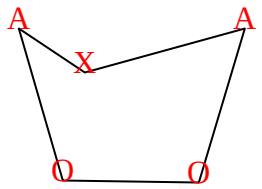


**1)**

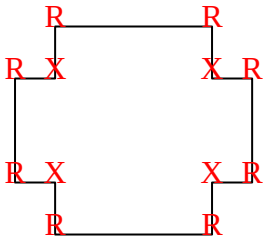


**2)**

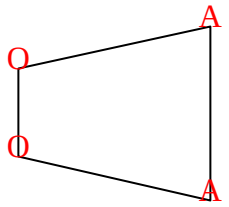


**3)**

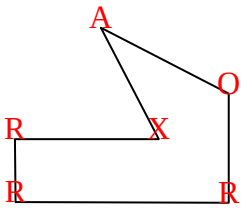


**4)**

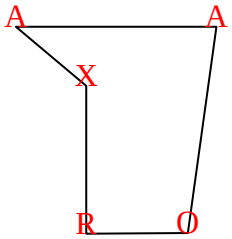


**5)**

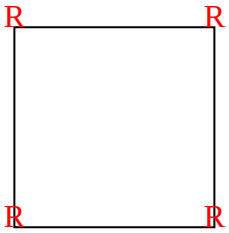


**6)**

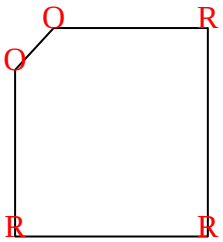


**7)**

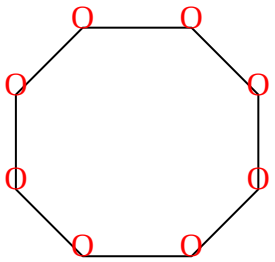


**8)**

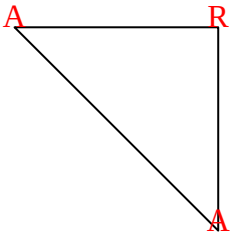


**9)**

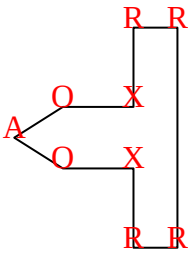


**10)**

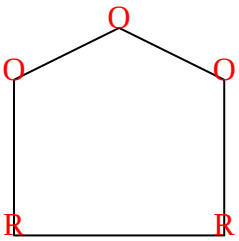


**11)**

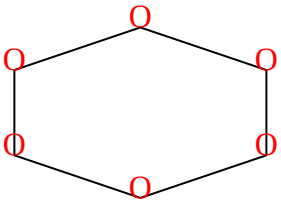


## Antworten

| | | | | |
|---|---|---|---|---|
| Bsp. | 2 | 2 | 0 | 1 |
| 1. | 0 | 0 | 8 | 4 |
| 2. | 2 | 2 | 0 | 0 |
| 3. | 1 | 1 | 3 | 1 |
| 4. | 2 | 1 | 1 | 1 |
| 5. | 0 | 0 | 4 | 0 |
| 6. | 0 | 2 | 3 | 0 |
| 7. | 0 | 8 | 0 | 0 |
| 8. | 2 | 0 | 1 | 0 |
| 9. | 1 | 2 | 4 | 2 |
| 10. | 0 | 3 | 2 | 0 |
| 11. | 0 | 0 | 6 | 0 |



| | | | | | | | | | | |
|---|---|---|---|---|---|---|---|---|---|---|
| 1-10 | 91 | 82 | 73 | 64 | 55 | 45 | 36 | 27 | 18 | 9 |
| 11 | 0 | | | | | | | | | |