Finden von Winkeln in Formen

Name:

Zähle die Anzahl von spitzwinkligen, stumpfwinkligen und rechten Winkeln in jeder Form.

Bsp)

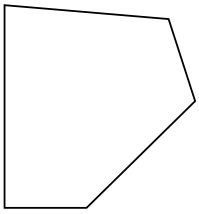

1)

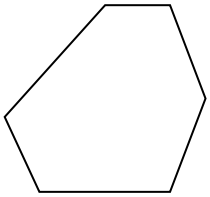

2)

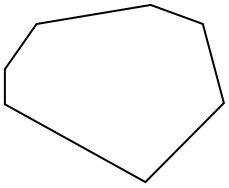

3)

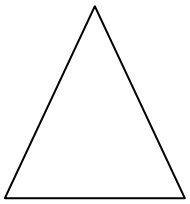

4)

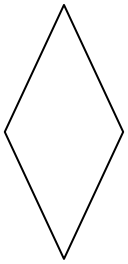

5)

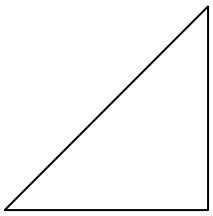

6)

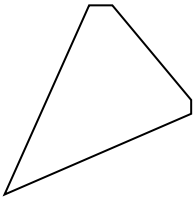

7)

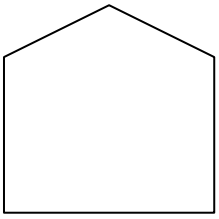

8)

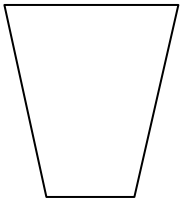

9)



10)

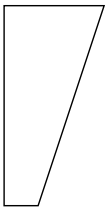

11)



Antworten

Bsp.	1	3	1
1.			
2.			
3.			
4.			
5.			
6.			
7.			
8.			
9.			
10.			
11.			

1-10	91	82	73	64	55	45	36	27	18	9
11	0									

Finden von Winkeln in Formen

Name: **Lösungsschlüssel**

Zähle die Anzahl von spitzwinkligen, stumpfwinkligen und rechten Winkeln in jeder Form.

Bsp)

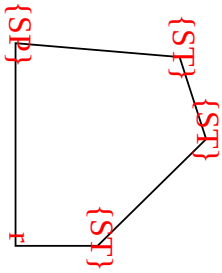

1)

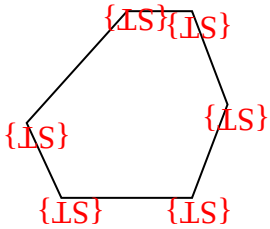

2)

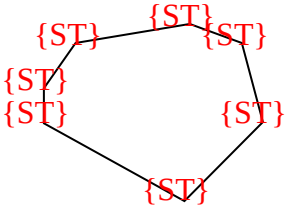

3)

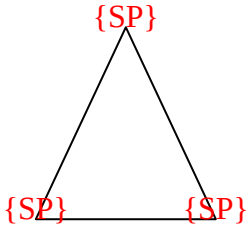

4)

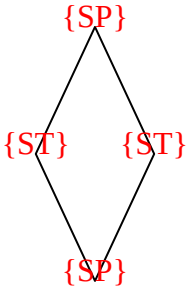

5)

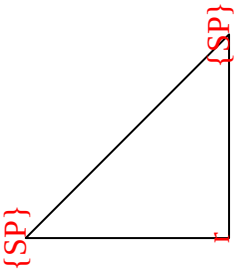

6)

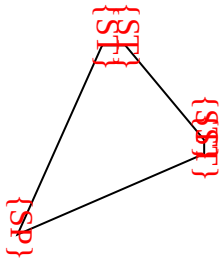

7)

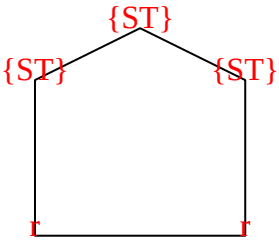

8)

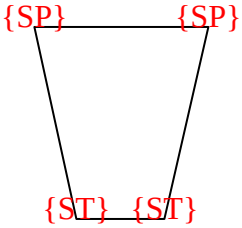

9)



10)

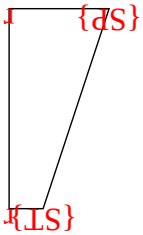

11)

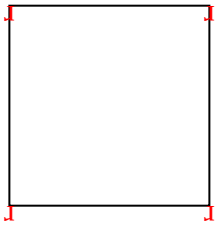

Antworten

Bsp.	1	3	1
1.	0	6	0
2.	0	7	0
3.	3	0	0
4.	2	2	0
5.	2	0	1
6.	1	4	0
7.	0	3	2
8.	2	2	0
9.	0	0	4
10.	1	1	2
11.	0	0	4

1-10	91	82	73	64	55	45	36	27	18	9
11	0									