# Feststellung von Winkeln mit Winkelmessern

Name:

**Benutze den Winkelmesser um den Winkelgrad zu finden.**

**1)**

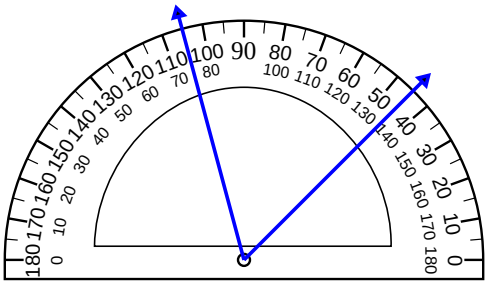

**2)**

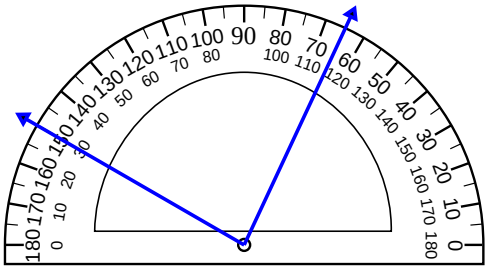

**3)**

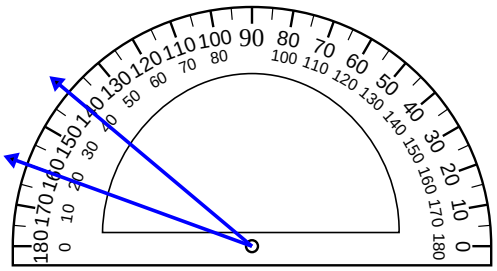

**4)**

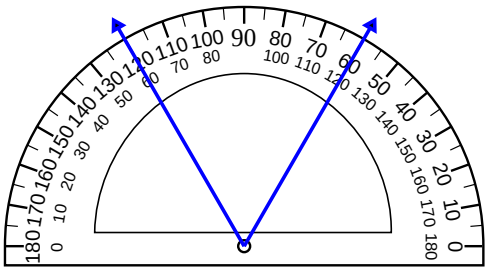

**5)**

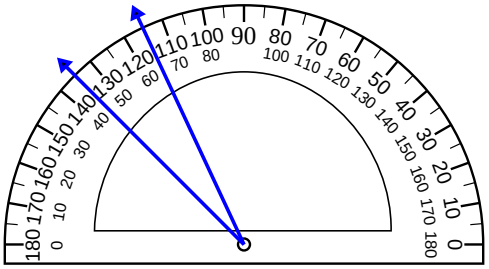

**6)**

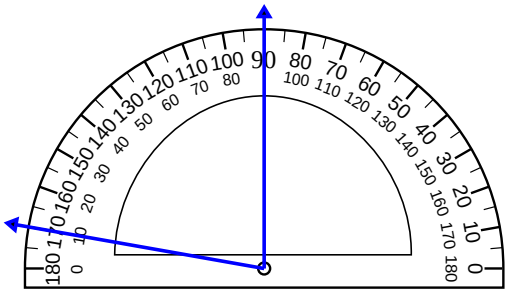

**7)**

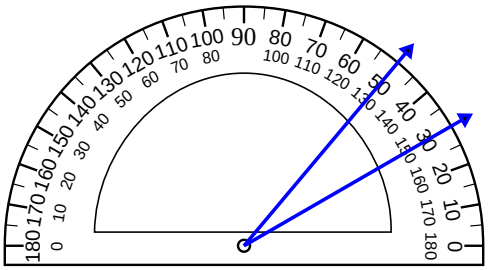

**8)**

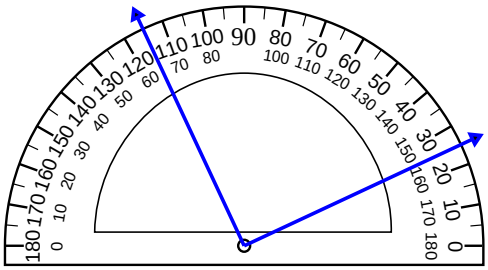

**9)**

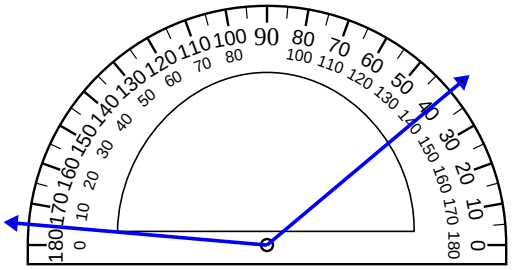

**10)**

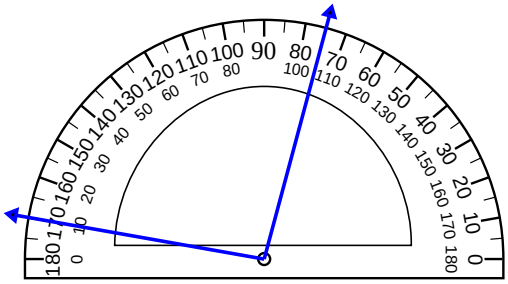

## Antworten

1. _____
2. _____
3. _____
4. _____
5. _____
6. _____
7. _____
8. _____
9. _____
10. _____



| 1-10 | 90 | 80 | 70 | 60 | 50 | 40 | 30 | 20 | 10 | 0 |
|---|---|---|---|---|---|---|---|---|---|---|

Feststellung von Winkeln mit Winkelmessern Name: **Lösungsschlüssel**

**Benutze den Winkelmesser um den Winkelgrad zu finden.**

1)

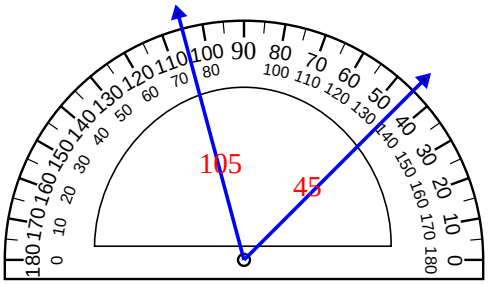


2)

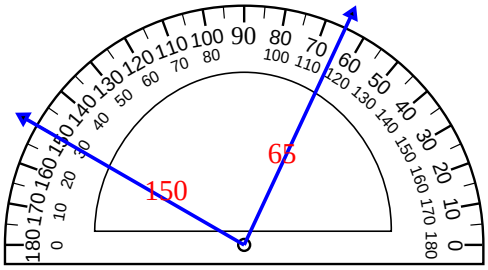


3)

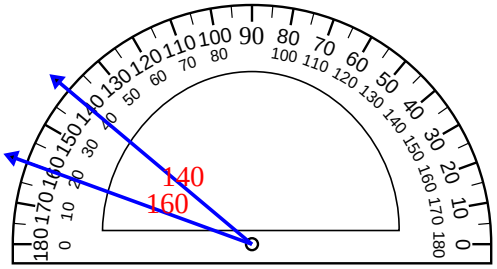


4)

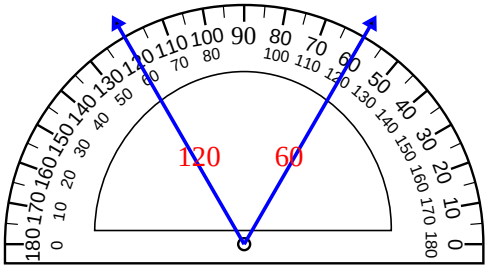


5)

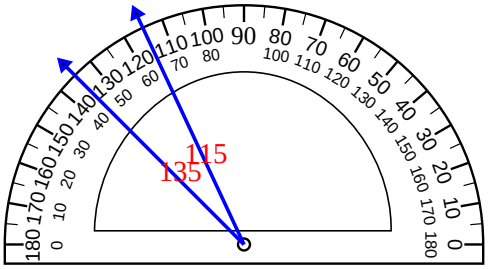


6)

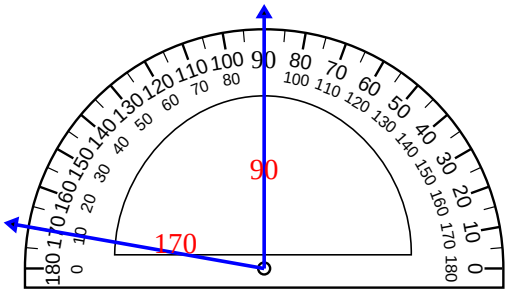


7)

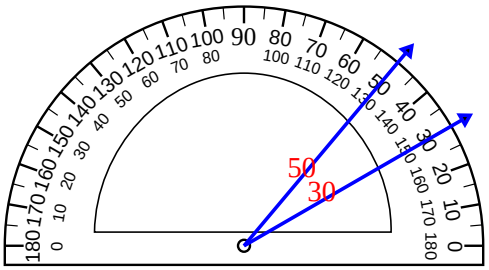


8)

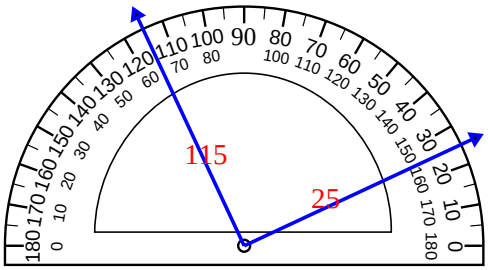


9)

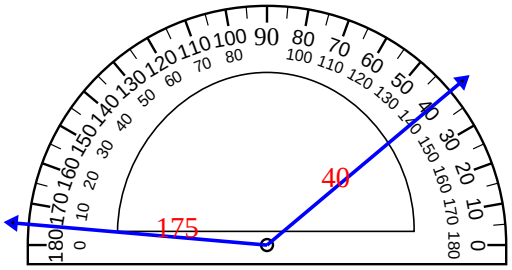


10)

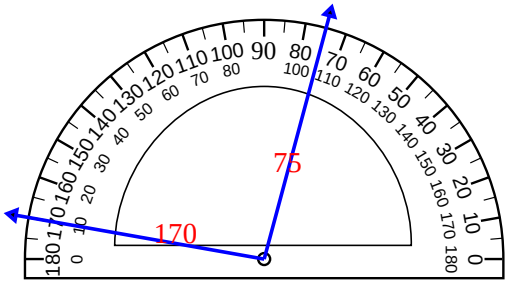


## Antworten

1. 60°
2. 85°
3. 20°
4. 60°
5. 20°
6. 80°
7. 20°
8. 90°
9. 135°
10. 95°



| 1-10 | 90 | 80 | 70 | 60 | 50 | 40 | 30 | 20 | 10 | 0 |
|---|---|---|---|---|---|---|---|---|---|---|

# Feststellung von Winkeln mit Winkelmessern

Name:

**Benutze den Winkelmesser um den Winkelgrad zu finden.**

1)

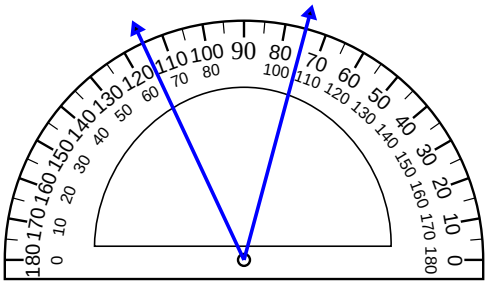

2)

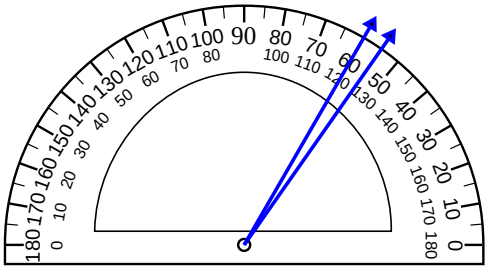

3)

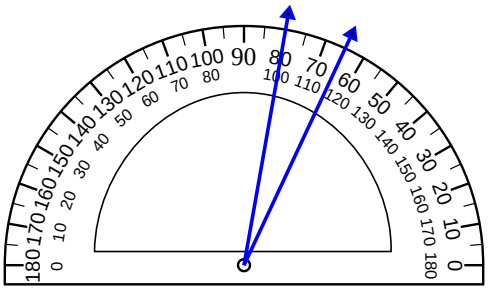

4)

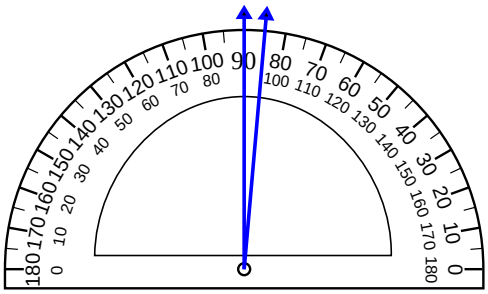

5)

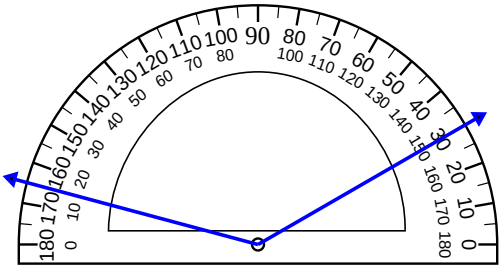

6)

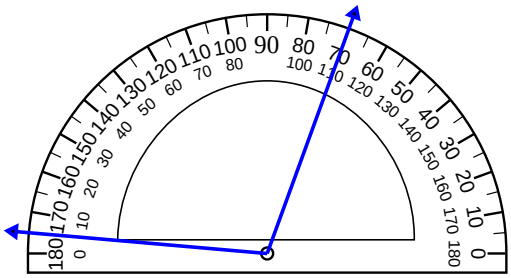

7)

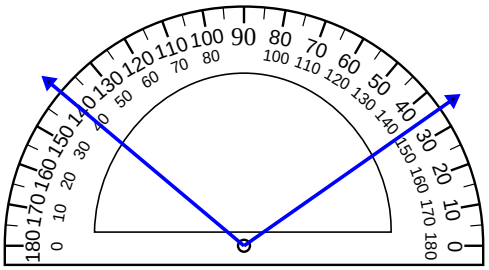

8)

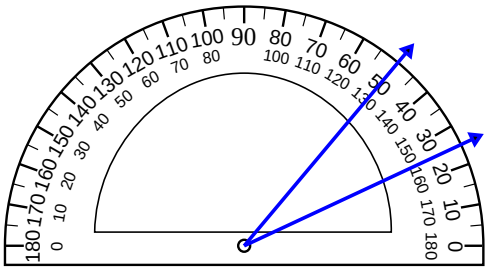

9)

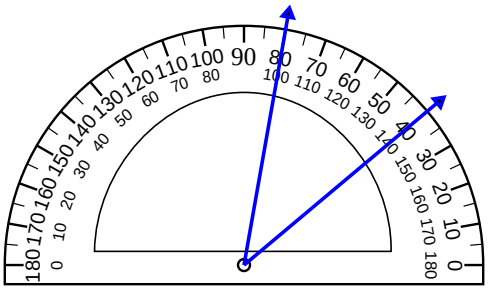

10)

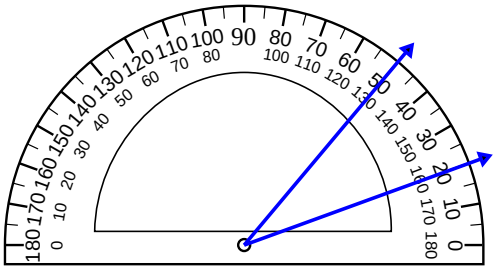

## Antworten

1. _____
2. _____
3. _____
4. _____
5. _____
6. _____
7. _____
8. _____
9. _____
10. _____



| 1-10 | 90 | 80 | 70 | 60 | 50 | 40 | 30 | 20 | 10 | 0 |
|---|---|---|---|---|---|---|---|---|---|---|

Feststellung von Winkeln mit Winkelmessern Name: **Lösungsschlüssel**

**Benutze den Winkelmesser um den Winkelgrad zu finden.**

1)

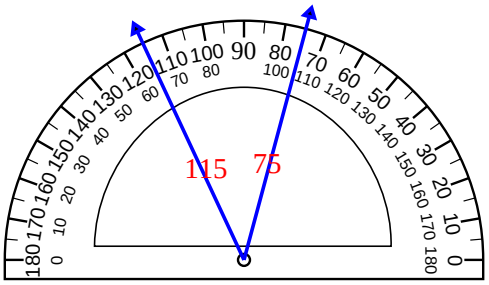


2)

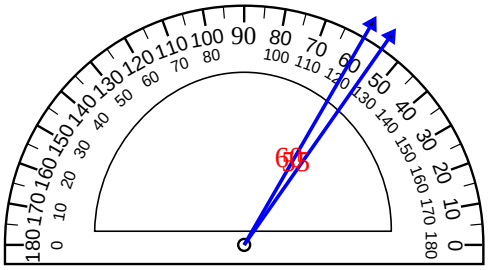


3)

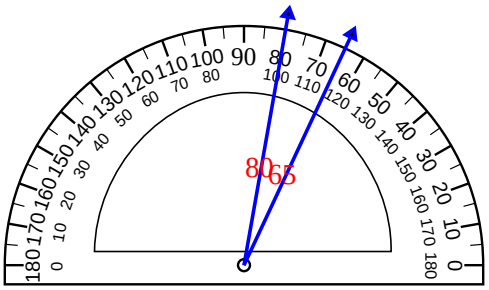


4)

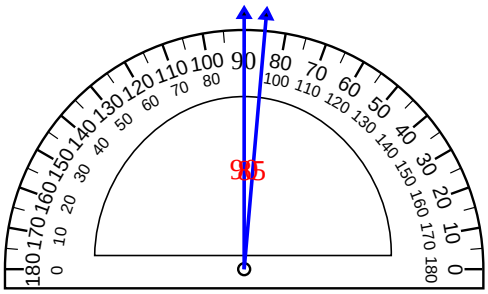


5)

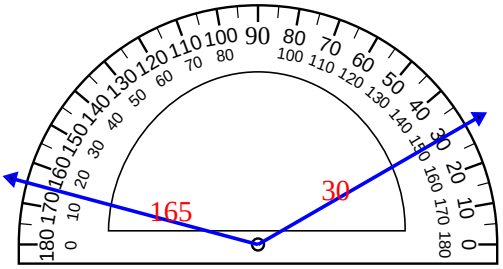


6)

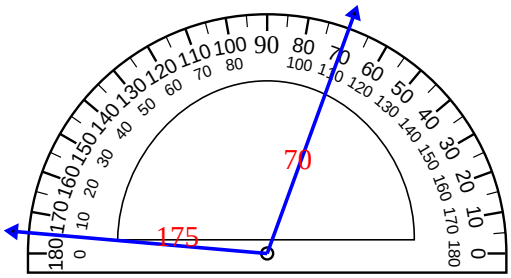


7)

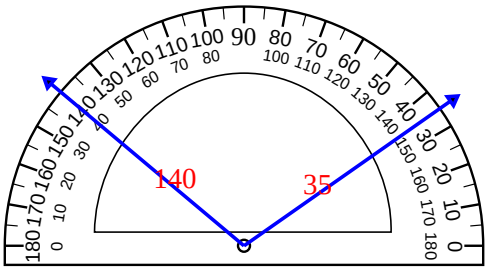


8)

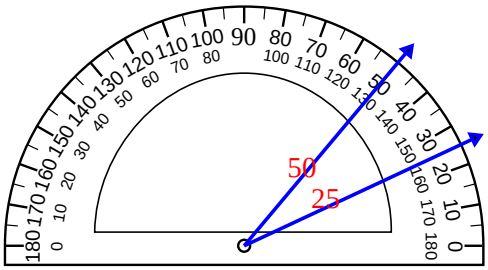


9)

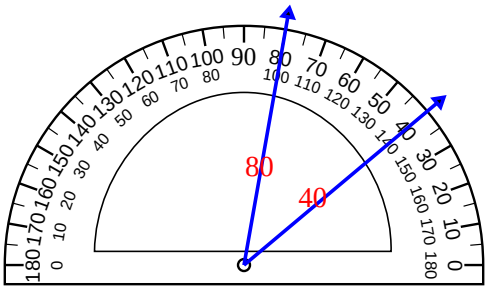


10)

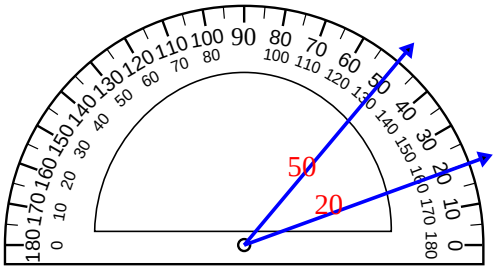


## Antworten

1. 40°
2. 5°
3. 15°
4. 5°
5. 135°
6. 105°
7. 105°
8. 25°
9. 40°
10. 30°



| 1-10 | 90 | 80 | 70 | 60 | 50 | 40 | 30 | 20 | 10 | 0 |
|---|---|---|---|---|---|---|---|---|---|---|

# Feststellung von Winkeln mit Winkelmessern

Name:

**Benutze den Winkelmesser um den Winkelgrad zu finden.**

**1)**

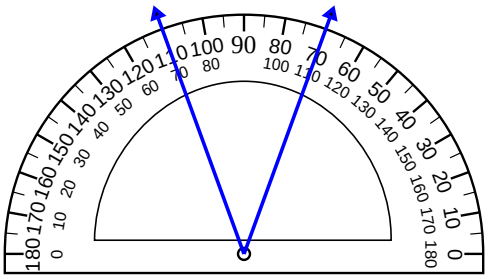

**2)**

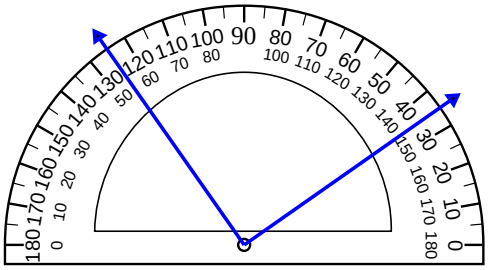

**3)**

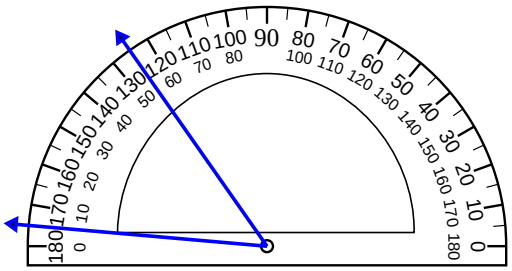

**4)**

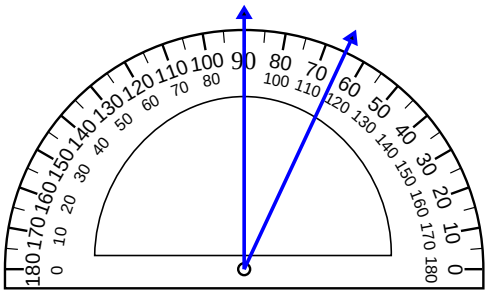

**5)**

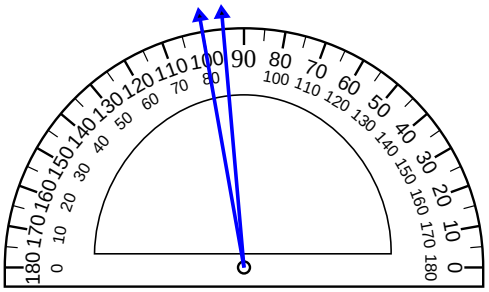

**6)**

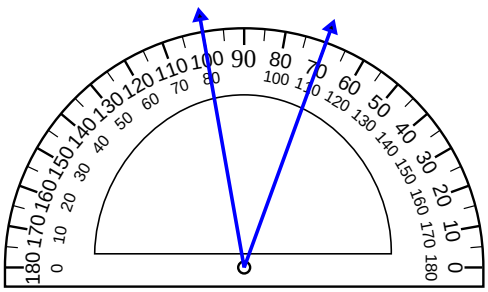

**7)**

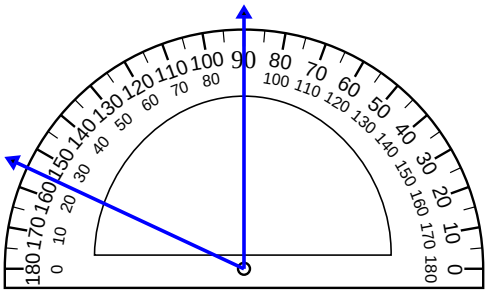

**8)**

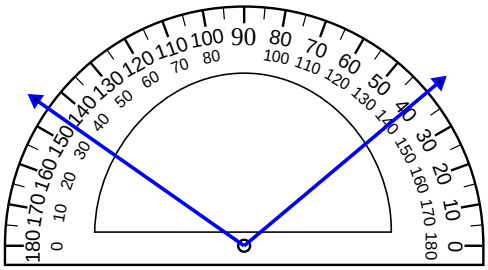

**9)**

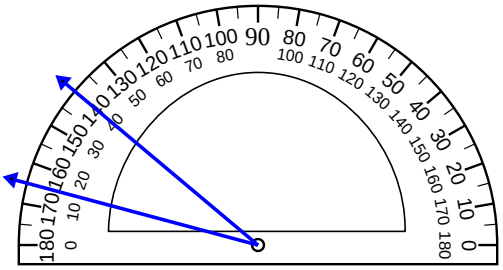

**10)**

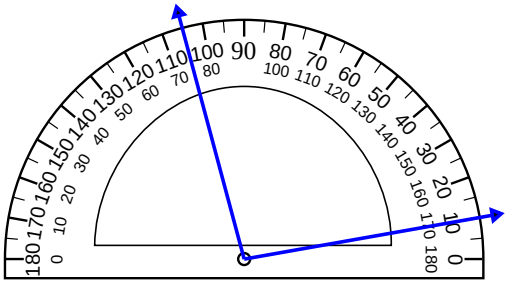

## Antworten

1. _____
2. _____
3. _____
4. _____
5. _____
6. _____
7. _____
8. _____
9. _____
10. _____



| 1-10 | 90 | 80 | 70 | 60 | 50 | 40 | 30 | 20 | 10 | 0 |
|---|---|---|---|---|---|---|---|---|---|---|

Feststellung von Winkeln mit Winkelmessern Name: **Lösungsschlüssel**

**Benutze den Winkelmesser um den Winkelgrad zu finden.**

1)

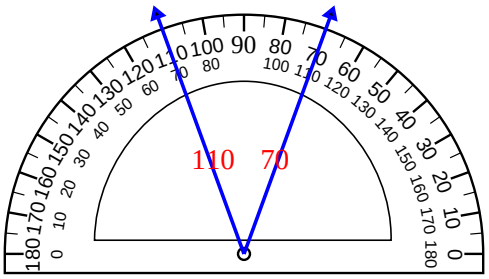


2)

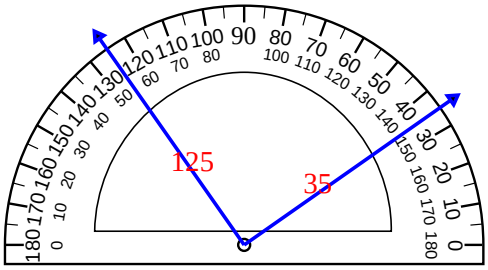


3)

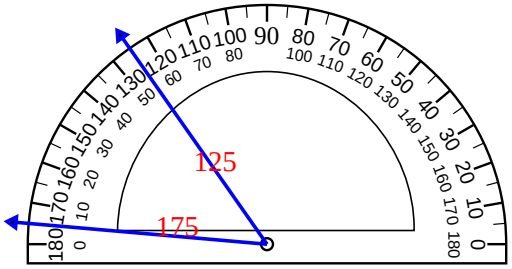


4)

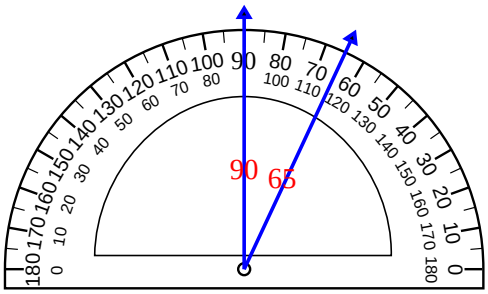


5)

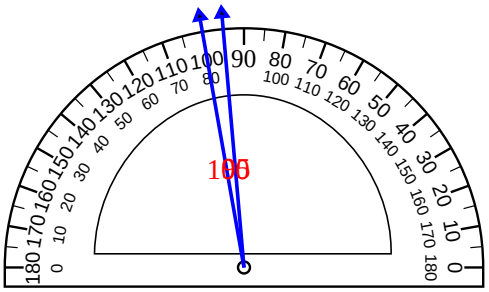


6)

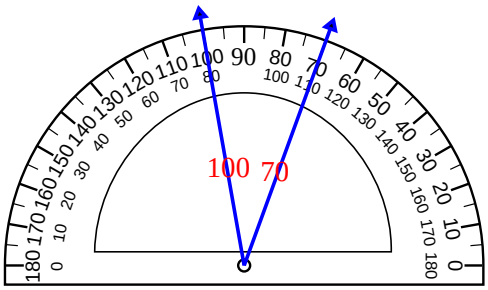


7)

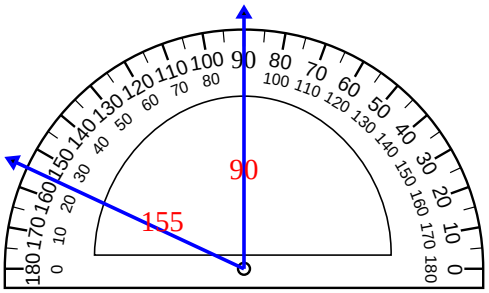


8)

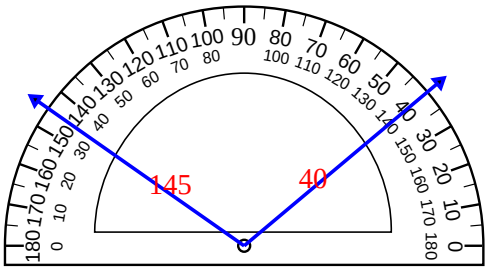


9)

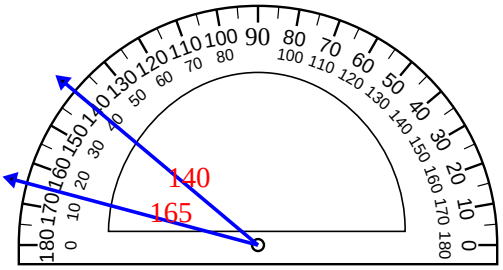


10)

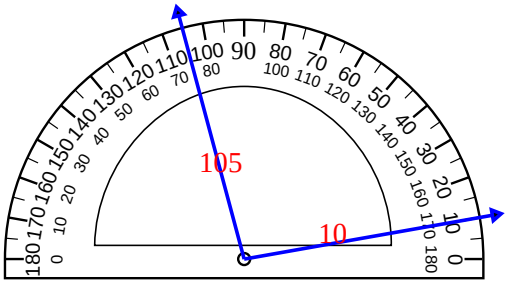


## Antworten

1. 40°
2. 90°
3. 50°
4. 25°
5. 5°
6. 30°
7. 65°
8. 105°
9. 25°
10. 95°



| 1-10 | 90 | 80 | 70 | 60 | 50 | 40 | 30 | 20 | 10 | 0 |
|---|---|---|---|---|---|---|---|---|---|---|

# Feststellung von Winkeln mit Winkelmessern

Name:

**Benutze den Winkelmesser um den Winkelgrad zu finden.**

**1)**

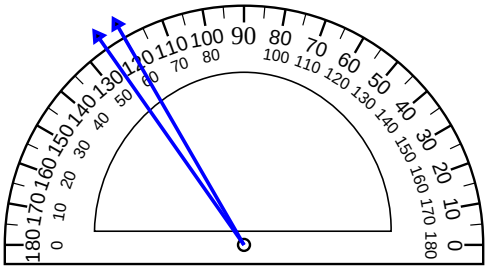

**2)**

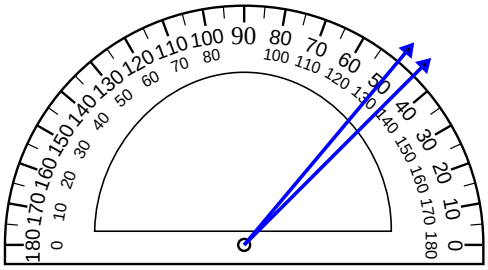

**3)**

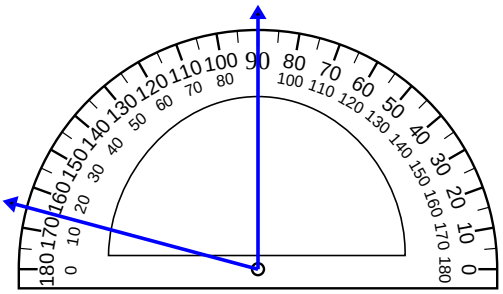

**4)**

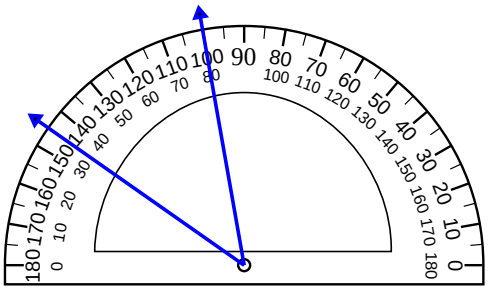

**5)**

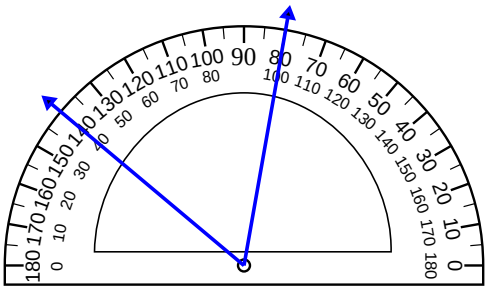

**6)**

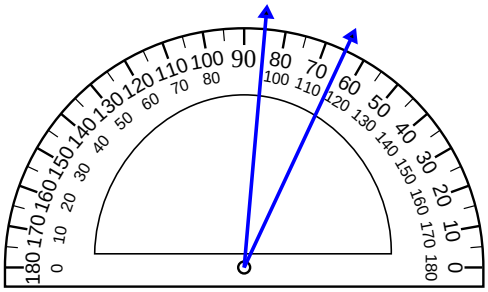

**7)**

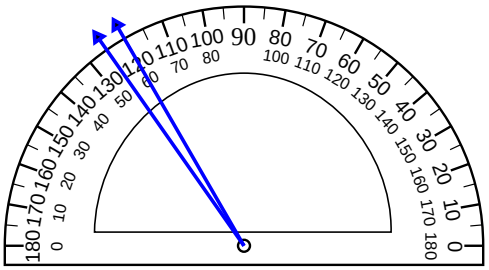

**8)**

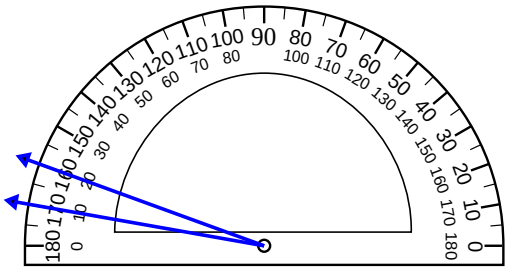

**9)**

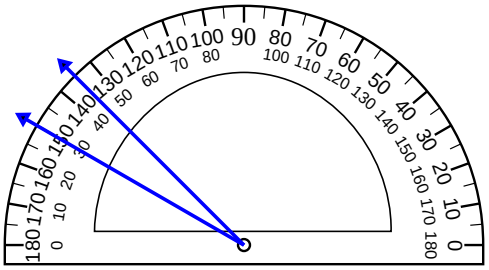

**10)**

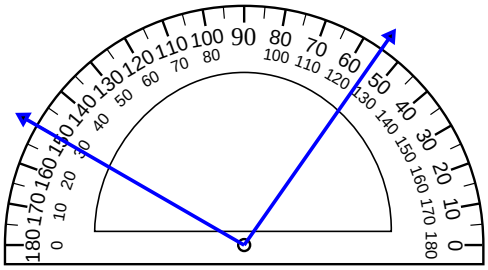

## Antworten

1. _____
2. _____
3. _____
4. _____
5. _____
6. _____
7. _____
8. _____
9. _____
10. _____



| 1-10 | 90 | 80 | 70 | 60 | 50 | 40 | 30 | 20 | 10 | 0 |
|---|---|---|---|---|---|---|---|---|---|---|

Feststellung von Winkeln mit Winkelmessern Name: **Lösungsschlüssel**

**Benutze den Winkelmesser um den Winkelgrad zu finden.**

1)

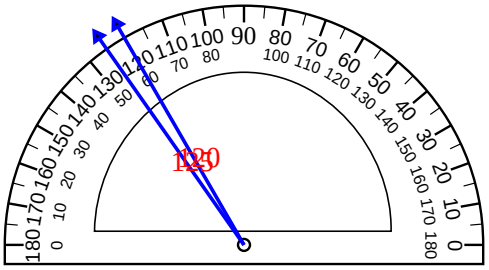


2)

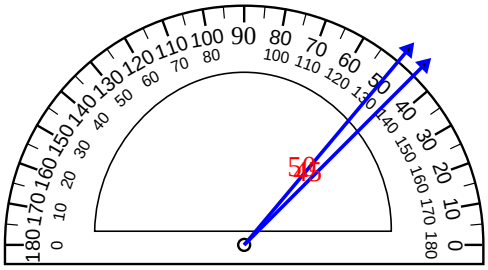


3)

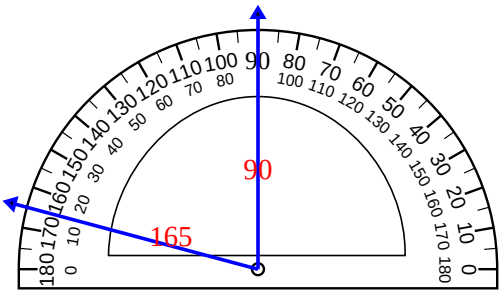


4)

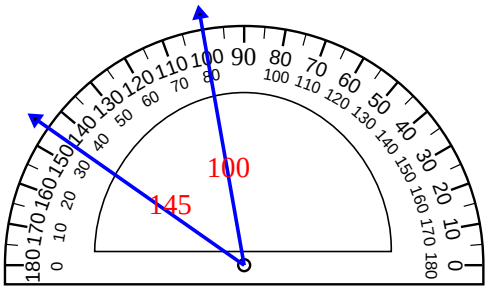


5)

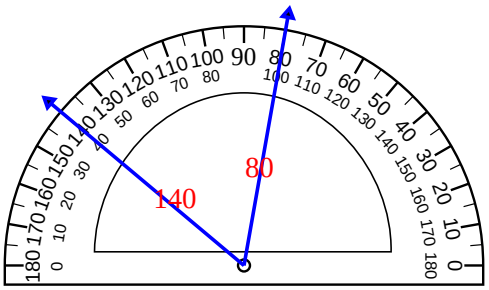


6)

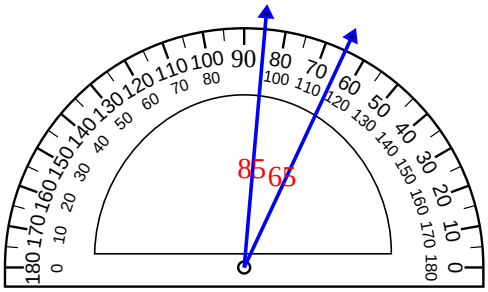


7)

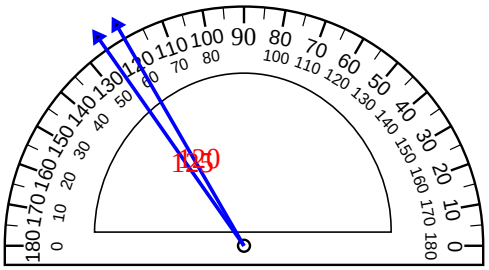


8)

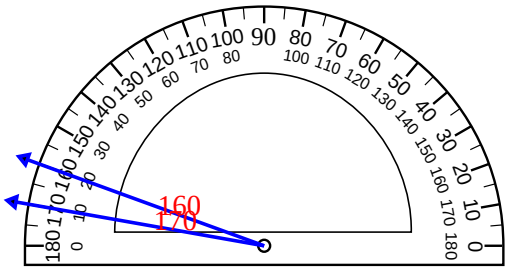


9)

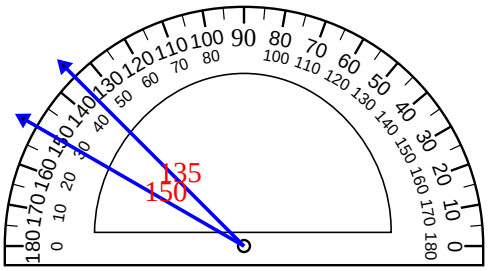


10)

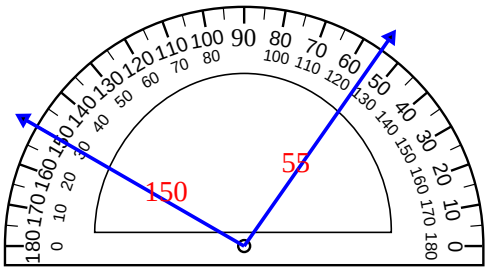


## Antworten

1. 5°
2. 5°
3. 75°
4. 45°
5. 60°
6. 20°
7. 5°
8. 10°
9. 15°
10. 95°



| 1-10 | 90 | 80 | 70 | 60 | 50 | 40 | 30 | 20 | 10 | 0 |
|---|---|---|---|---|---|---|---|---|---|---|

# Feststellung von Winkeln mit Winkelmessern

Name:

**Benutze den Winkelmesser um den Winkelgrad zu finden.**

**1)**

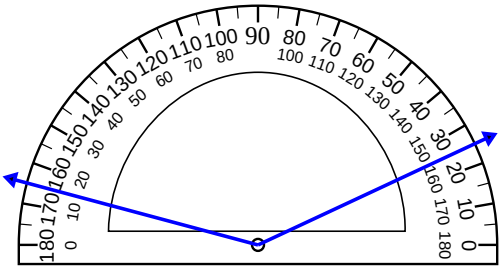

**2)**

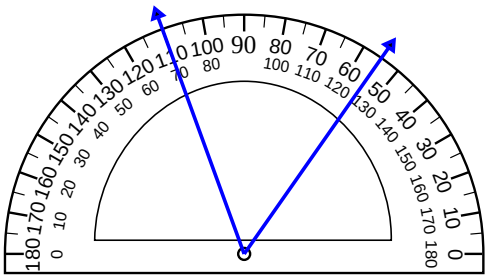

**3)**

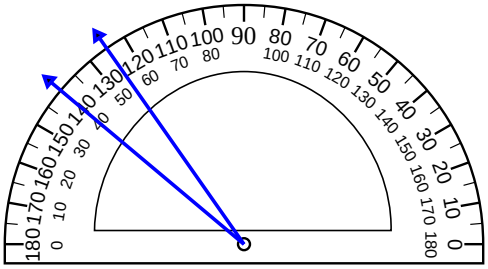

**4)**

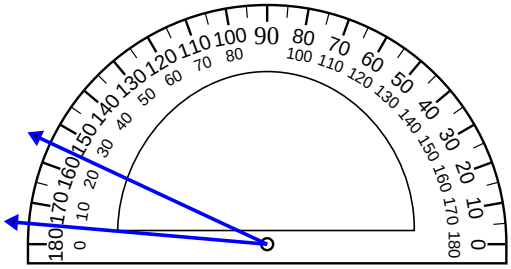

**5)**

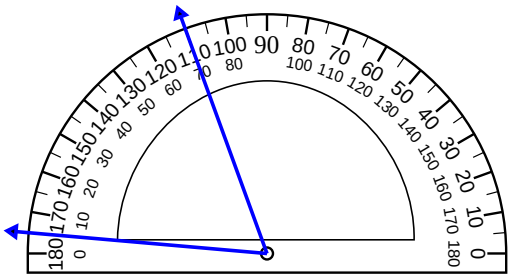

**6)**

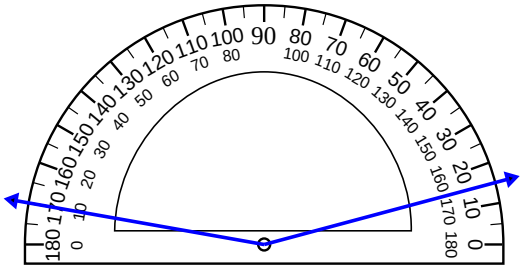

**7)**

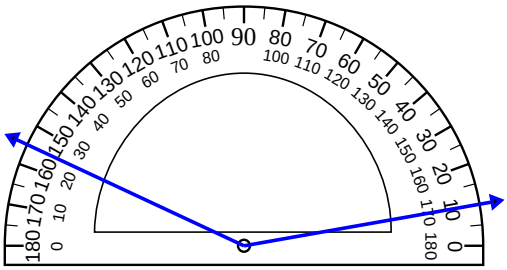

**8)**

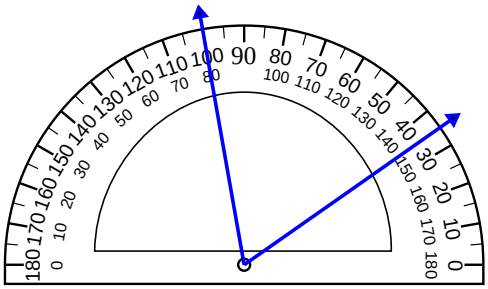

**9)**

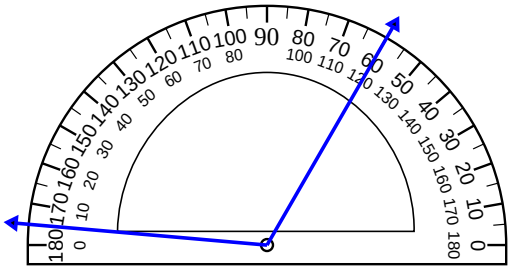

**10)**

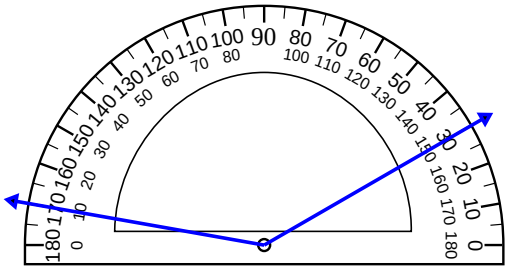

## Antworten

1. _____
2. _____
3. _____
4. _____
5. _____
6. _____
7. _____
8. _____
9. _____
10. _____

| 1-10 | 90 | 80 | 70 | 60 | 50 | 40 | 30 | 20 | 10 | 0 |
|---|---|---|---|---|---|---|---|---|---|---|

Feststellung von Winkeln mit Winkelmessern Name: **Lösungsschlüssel**

**Benutze den Winkelmesser um den Winkelgrad zu finden.**

**1)**

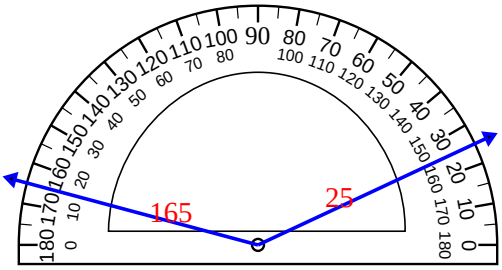


**2)**

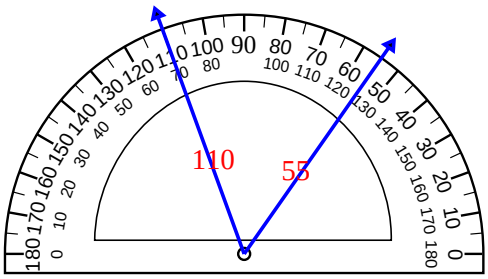


**3)**

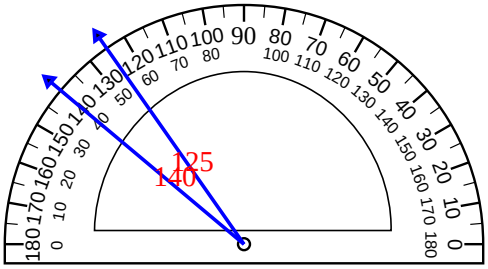


**4)**

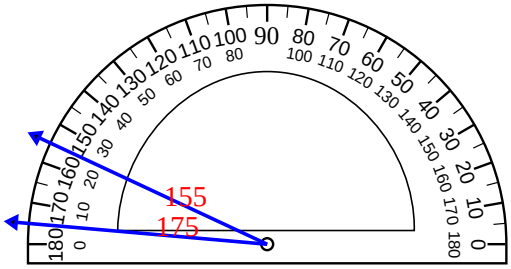


**5)**

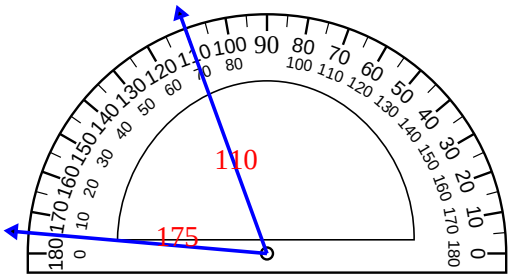


**6)**

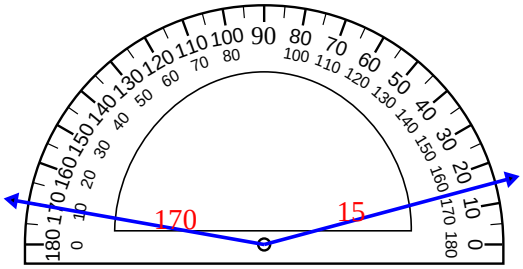


**7)**

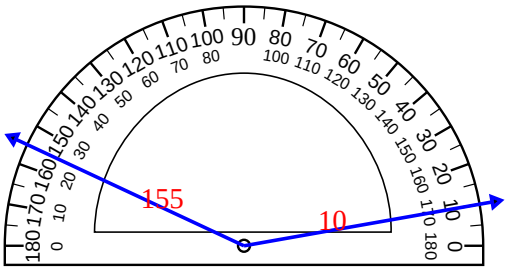


**8)**

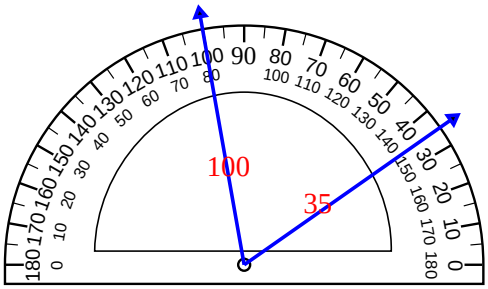


**9)**

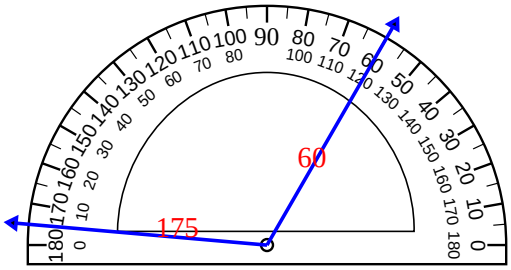


**10)**

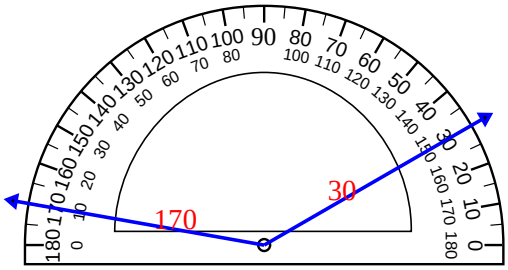


## Antworten

1. 140°
2. 55°
3. 15°
4. 20°
5. 65°
6. 155°
7. 145°
8. 65°
9. 115°
10. 140°



| 1-10 | 90 | 80 | 70 | 60 | 50 | 40 | 30 | 20 | 10 | 0 |
|---|---|---|---|---|---|---|---|---|---|---|

# Feststellung von Winkeln mit Winkelmessern

Name:

**Benutze den Winkelmesser um den Winkelgrad zu finden.**

**1)**

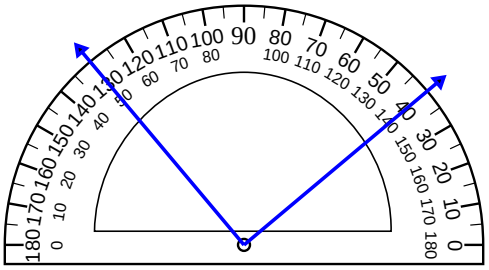

**2)**

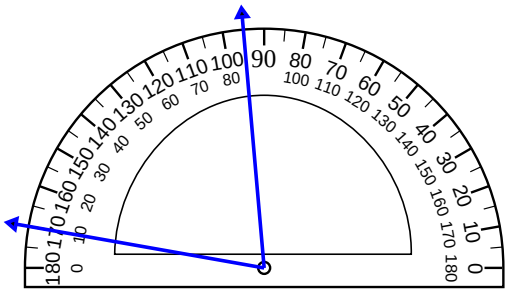

**3)**

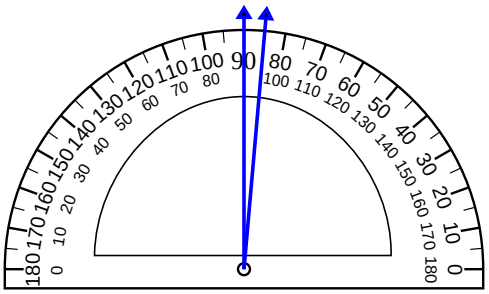

**4)**

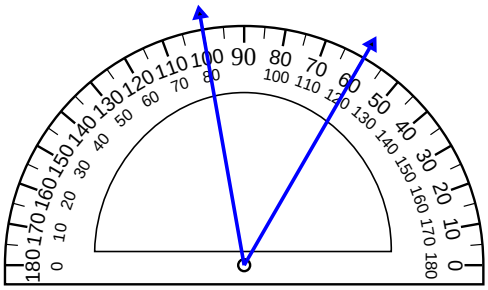

**5)**

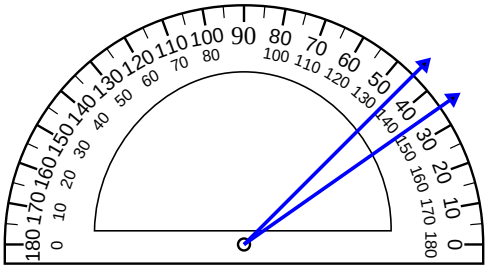

**6)**

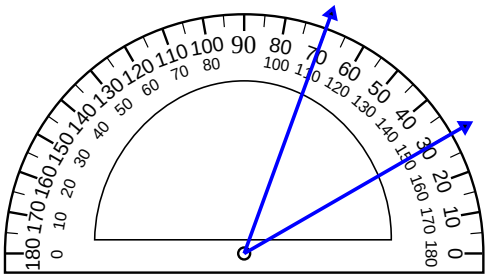

**7)**

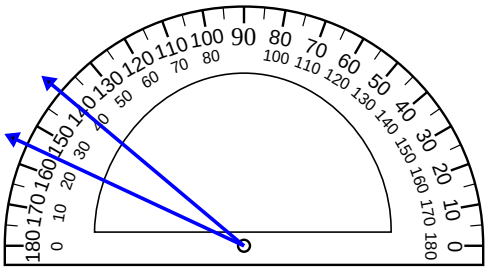

**8)**

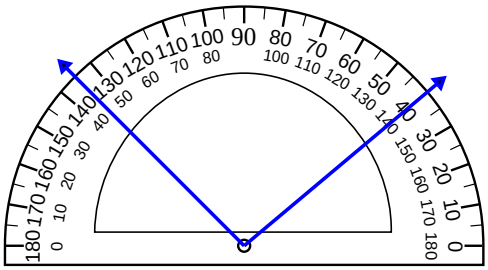

**9)**

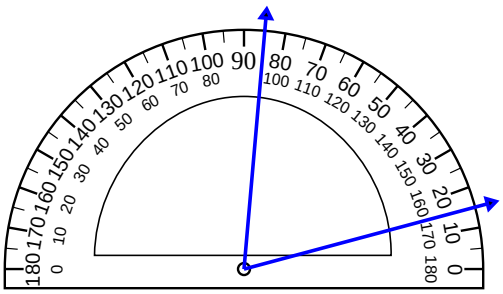

**10)**

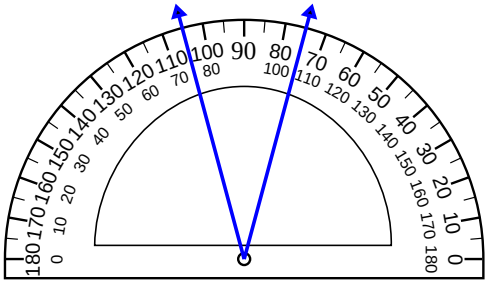

## Antworten

1. _____
2. _____
3. _____
4. _____
5. _____
6. _____
7. _____
8. _____
9. _____
10. _____



| 1-10 | 90 | 80 | 70 | 60 | 50 | 40 | 30 | 20 | 10 | 0 |
|---|---|---|---|---|---|---|---|---|---|---|

Feststellung von Winkeln mit Winkelmessern Name: **Lösungsschlüssel**

**Benutze den Winkelmesser um den Winkelgrad zu finden.**

1)

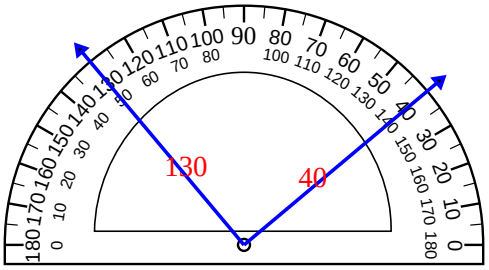


2)

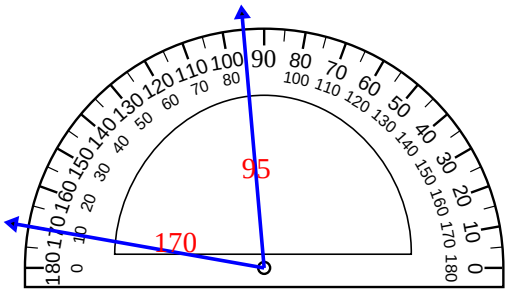


3)

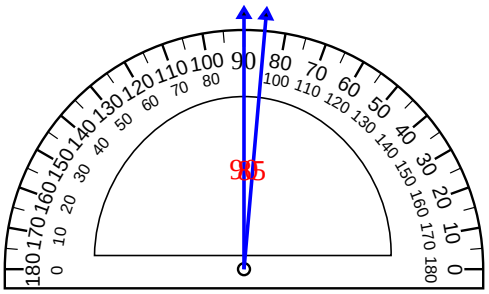


4)

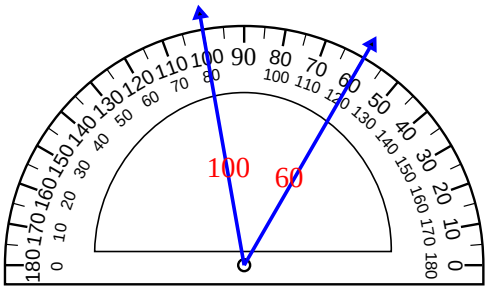


5)

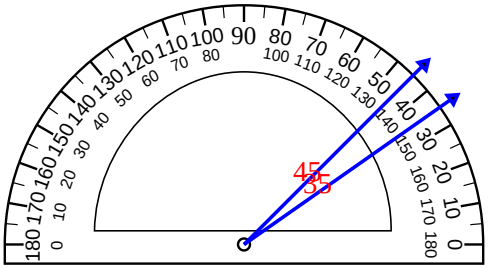


6)

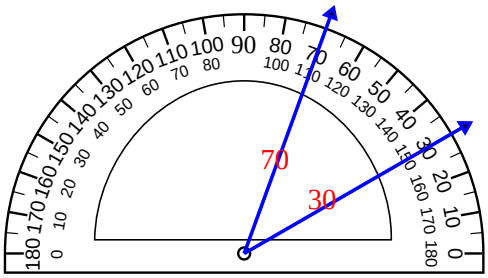


7)

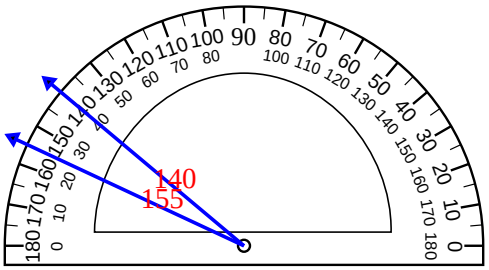


8)

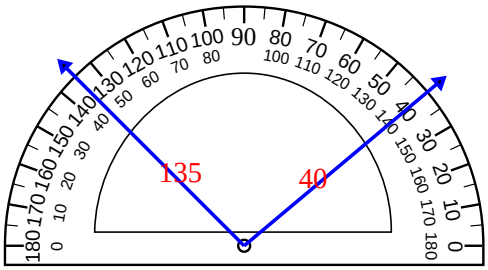


9)

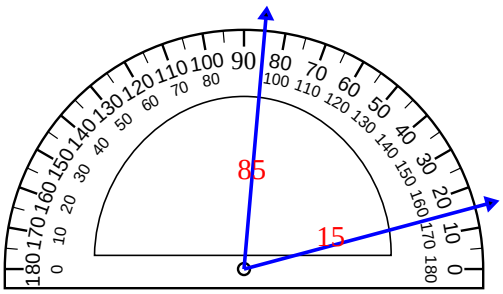


10)

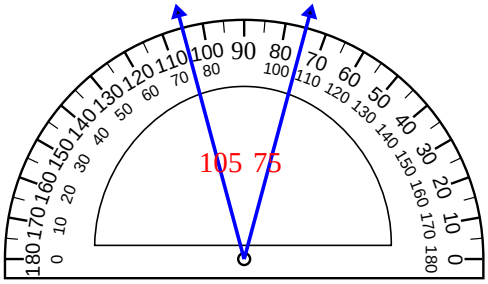


## Antworten

1. 90°
2. 75°
3. 5°
4. 40°
5. 10°
6. 40°
7. 15°
8. 95°
9. 70°
10. 30°



| 1-10 | 90 | 80 | 70 | 60 | 50 | 40 | 30 | 20 | 10 | 0 |
|---|---|---|---|---|---|---|---|---|---|---|

# Feststellung von Winkeln mit Winkelmessern

Name:

**Benutze den Winkelmesser um den Winkelgrad zu finden.**

**1)**

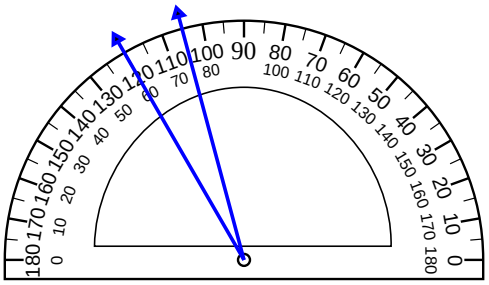

**2)**

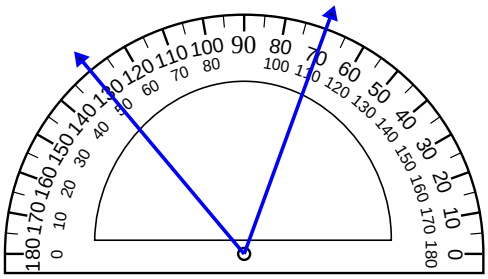

**3)**

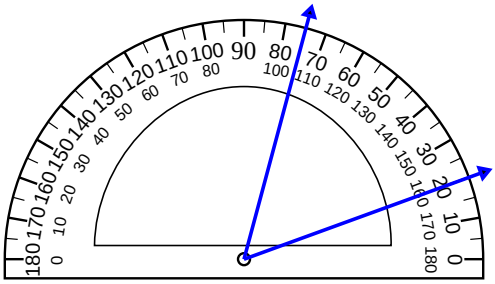

**4)**

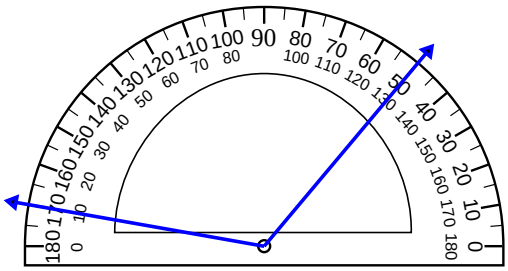

**5)**

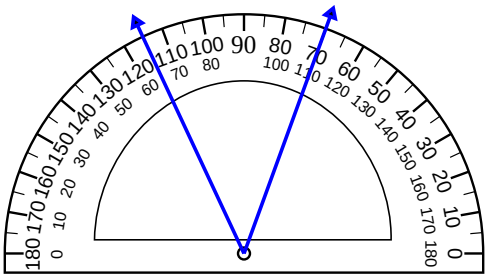

**6)**

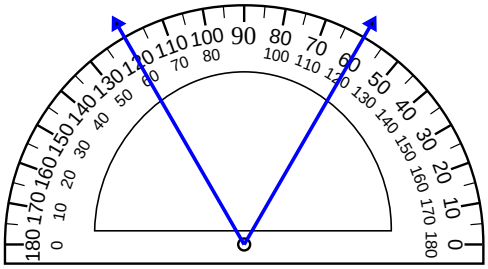

**7)**

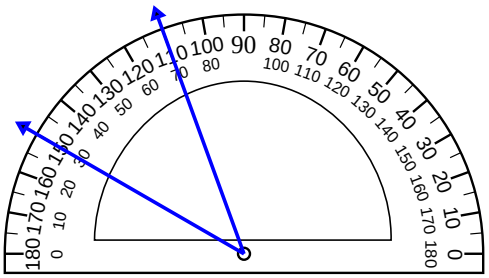

**8)**

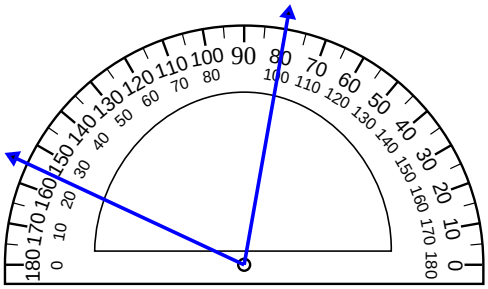

**9)**

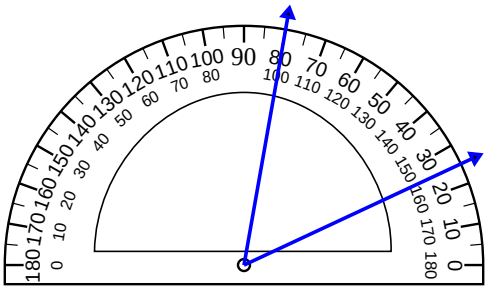

**10)**

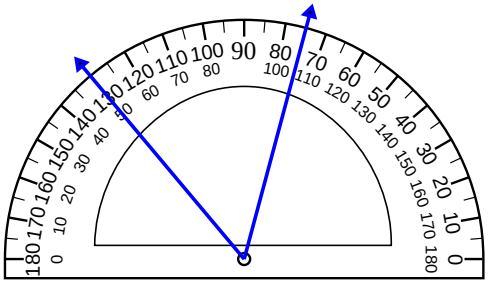

## Antworten

1. _____
2. _____
3. _____
4. _____
5. _____
6. _____
7. _____
8. _____
9. _____
10. _____



| 1-10 | 90 | 80 | 70 | 60 | 50 | 40 | 30 | 20 | 10 | 0 |
|---|---|---|---|---|---|---|---|---|---|---|

Feststellung von Winkeln mit Winkelmessern Name: **Lösungsschlüssel**

**Benutze den Winkelmesser um den Winkelgrad zu finden.**

1)

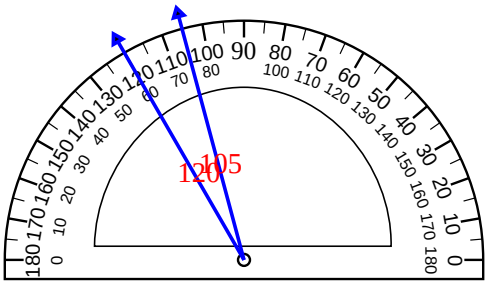


2)

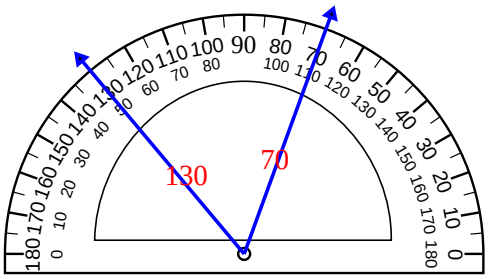


3)

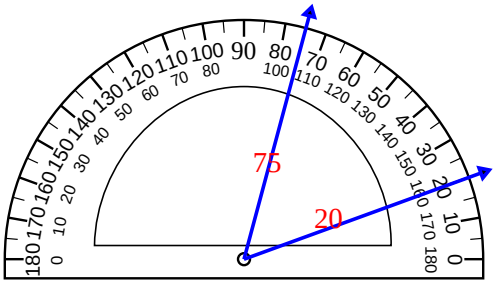


4)

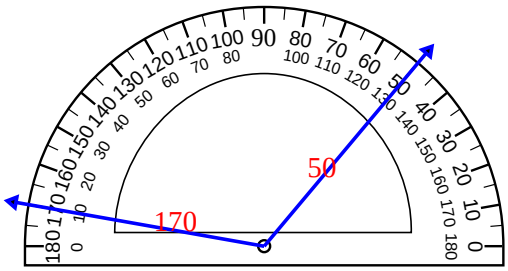


5)

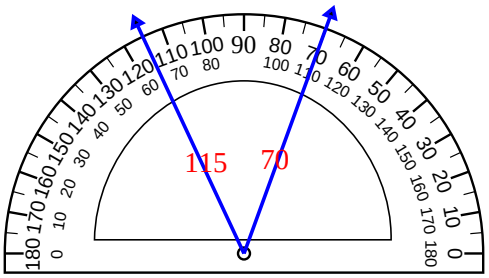


6)

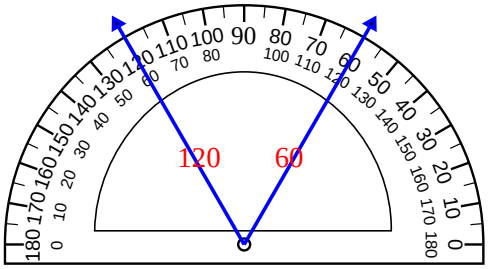


7)

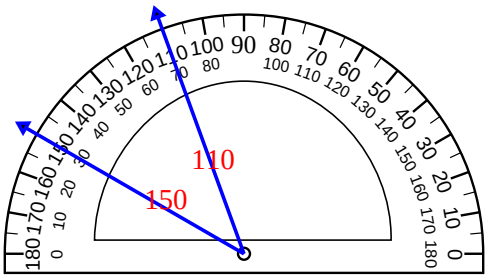


8)

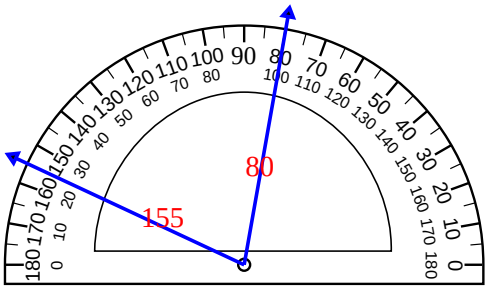


9)

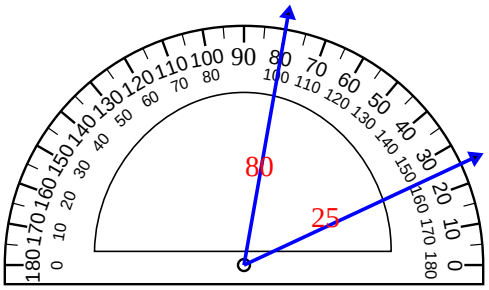


10)

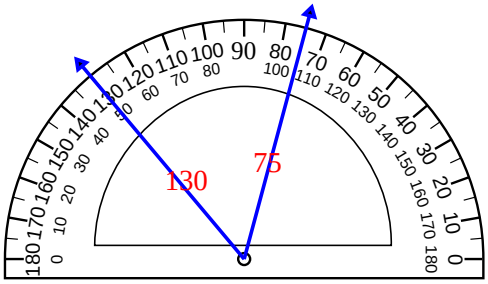


## Antworten

1. 15°
2. 60°
3. 55°
4. 120°
5. 45°
6. 60°
7. 40°
8. 75°
9. 55°
10. 55°



| 1-10 | 90 | 80 | 70 | 60 | 50 | 40 | 30 | 20 | 10 | 0 |
|---|---|---|---|---|---|---|---|---|---|---|

# Feststellung von Winkeln mit Winkelmessern

Name:

**Benutze den Winkelmesser um den Winkelgrad zu finden.**

**1)**

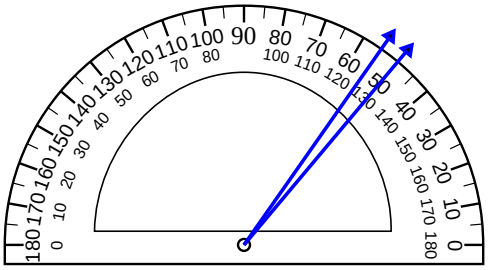

**2)**

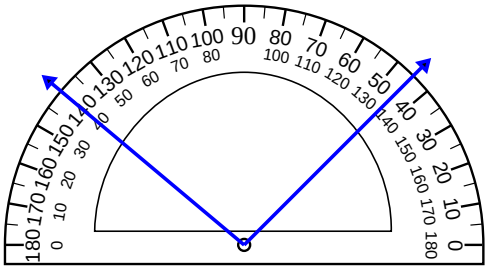

**3)**

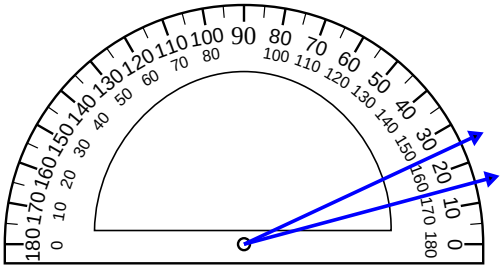

**4)**

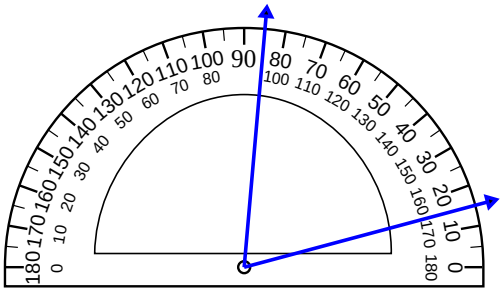

**5)**

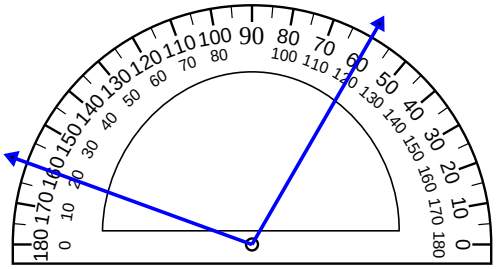

**6)**

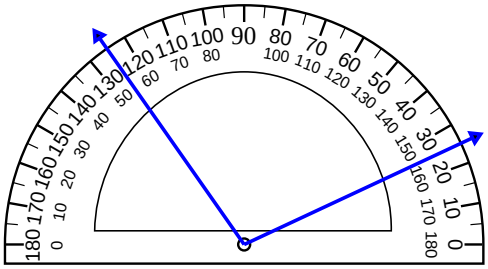

**7)**

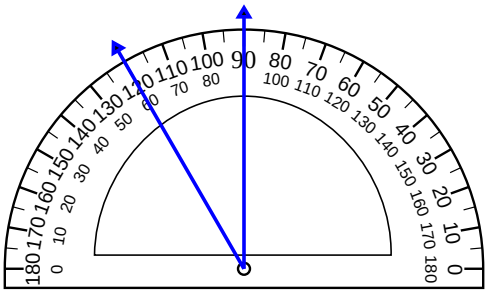

**8)**

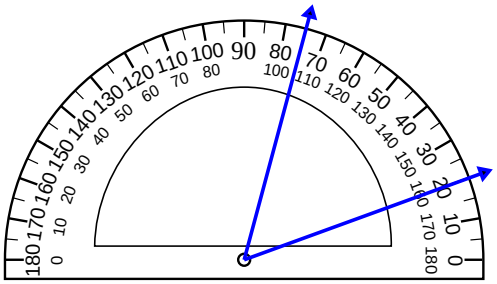

**9)**

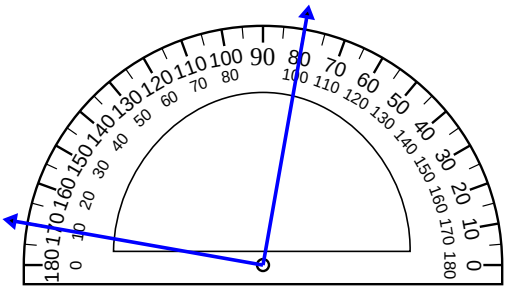

**10)**

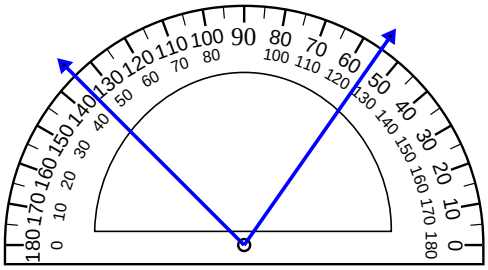

## Antworten

1. _____
2. _____
3. _____
4. _____
5. _____
6. _____
7. _____
8. _____
9. _____
10. _____

| 1-10 | 90 | 80 | 70 | 60 | 50 | 40 | 30 | 20 | 10 | 0 |
|---|---|---|---|---|---|---|---|---|---|---|

Feststellung von Winkeln mit Winkelmessern Name: **Lösungsschlüssel**

**Benutze den Winkelmesser um den Winkelgrad zu finden.**

**1)**

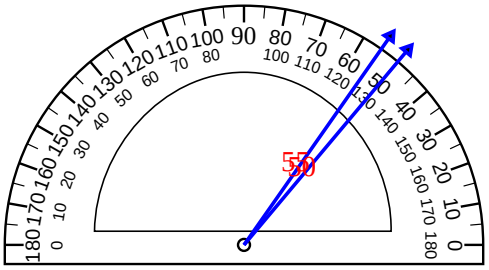


**2)**

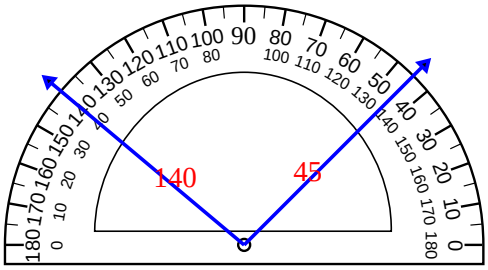


**3)**

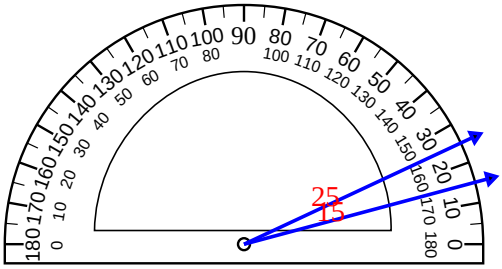


**4)**

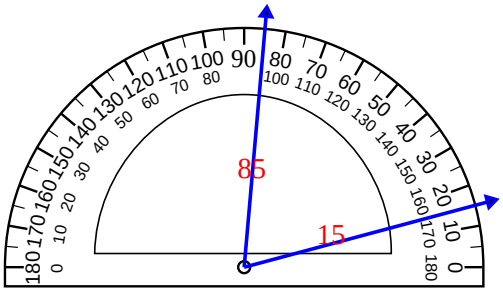


**5)**

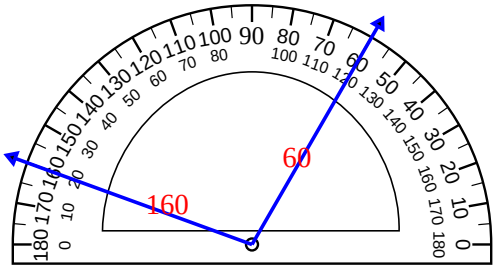


**6)**

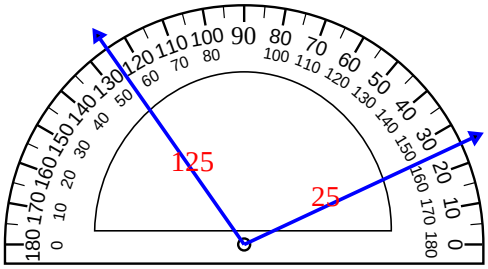


**7)**

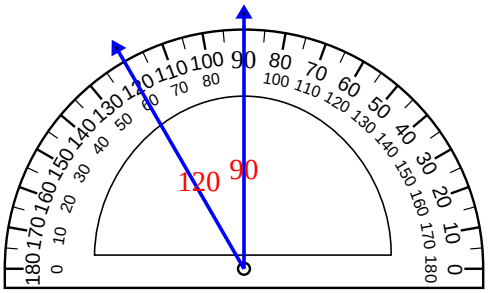


**8)**

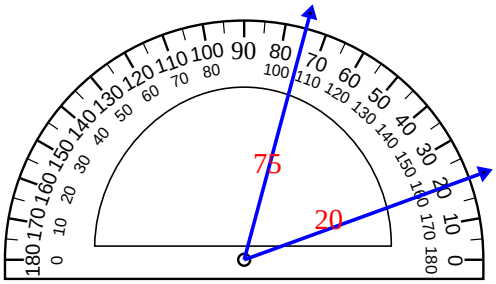


**9)**

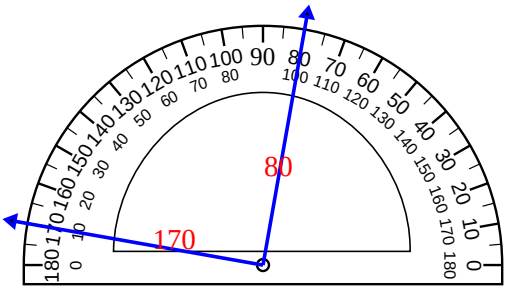


**10)**

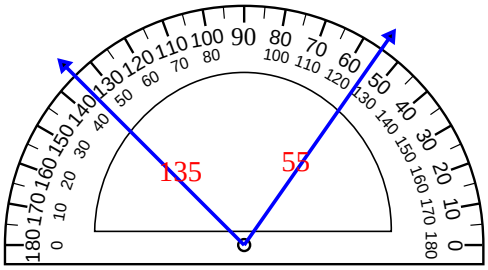


## Antworten

1. 5°
2. 95°
3. 10°
4. 70°
5. 100°
6. 100°
7. 30°
8. 55°
9. 90°
10. 80°



| 1-10 | 90 | 80 | 70 | 60 | 50 | 40 | 30 | 20 | 10 | 0 |
|---|---|---|---|---|---|---|---|---|---|---|

# Feststellung von Winkeln mit Winkelmessern

Name:

**Benutze den Winkelmesser um den Winkelgrad zu finden.**

1)

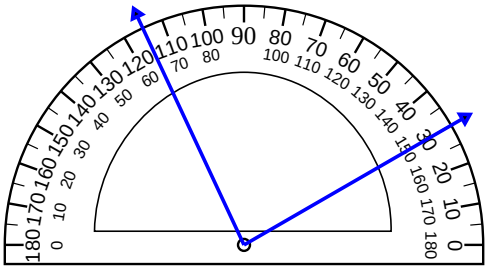

2)

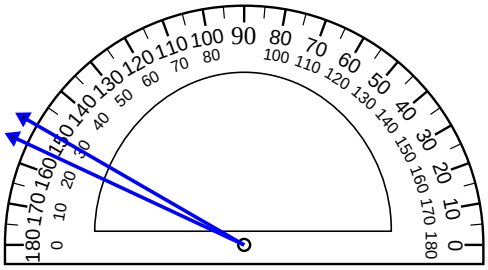

3)

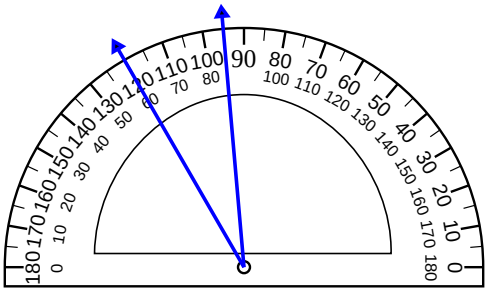

4)

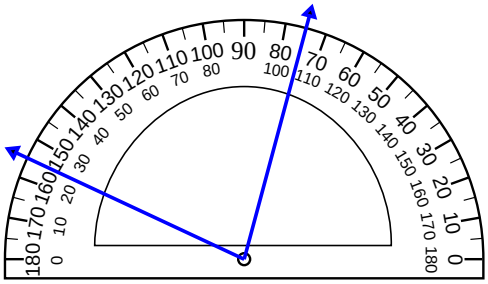

5)

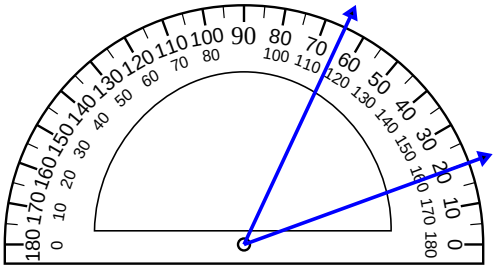

6)

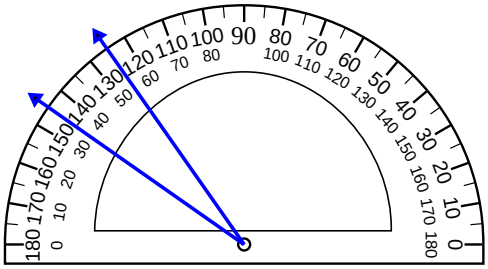

7)

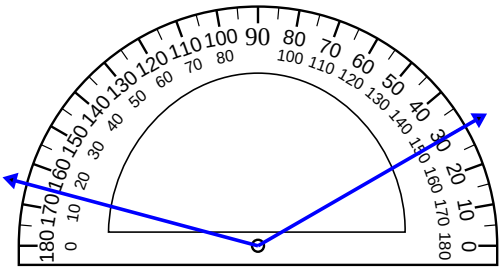

8)

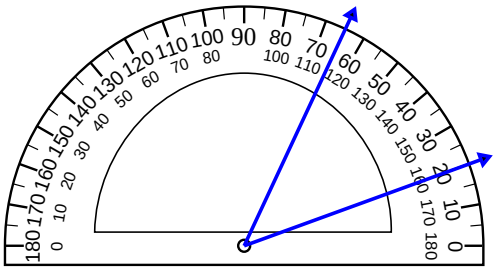

9)

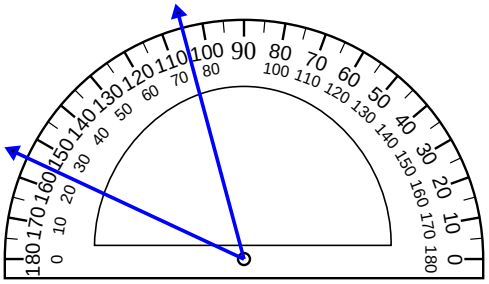

10)

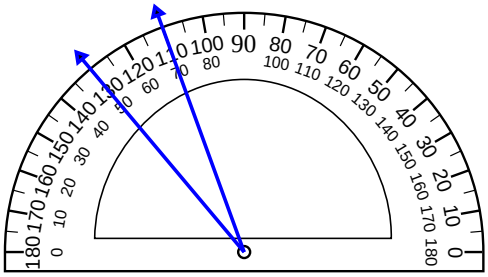

## Antworten

1. _____
2. _____
3. _____
4. _____
5. _____
6. _____
7. _____
8. _____
9. _____
10. _____



| 1-10 | 90 | 80 | 70 | 60 | 50 | 40 | 30 | 20 | 10 | 0 |
|---|---|---|---|---|---|---|---|---|---|---|

Feststellung von Winkeln mit Winkelmessern Name: **Lösungsschlüssel**

**Benutze den Winkelmesser um den Winkelgrad zu finden.**

1)

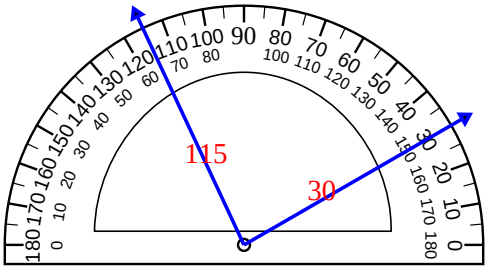


2)

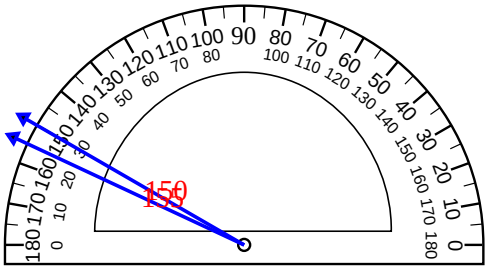


3)

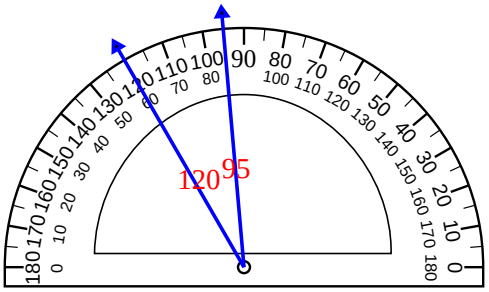


4)

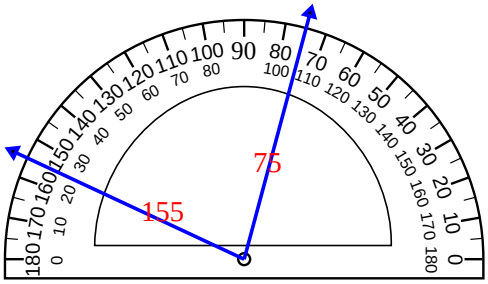


5)

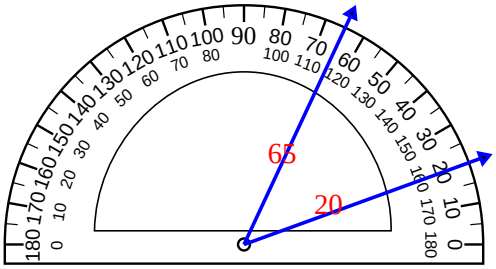


6)

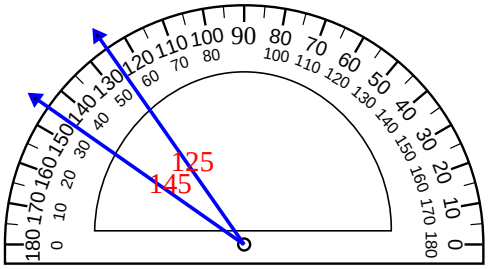


7)

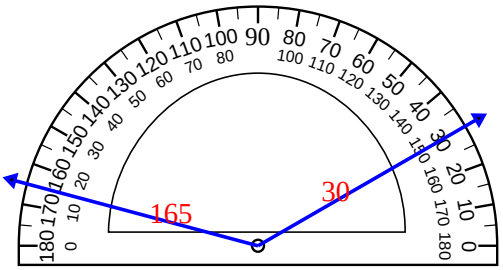


8)

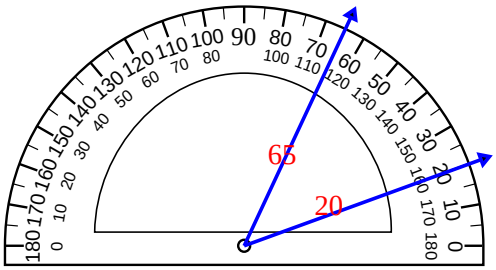


9)

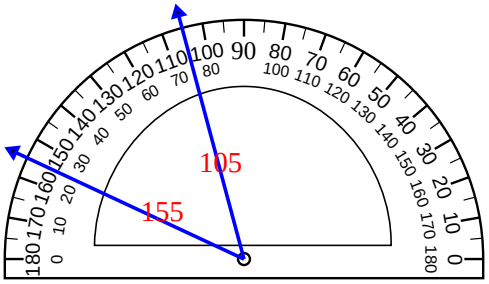


10)

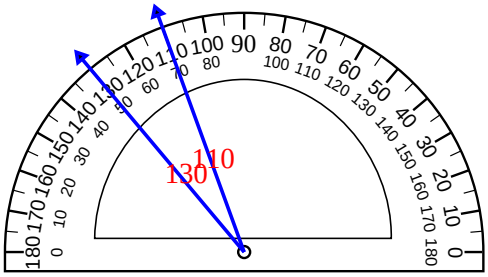


## Antworten

1. **85°**
2. **5°**
3. **25°**
4. **80°**
5. **45°**
6. **20°**
7. **135°**
8. **45°**
9. **50°**
10. **20°**



| 1-10 | 90 | 80 | 70 | 60 | 50 | 40 | 30 | 20 | 10 | 0 |
|---|---|---|---|---|---|---|---|---|---|---|

# Feststellung von Winkeln mit Winkelmessern

Name:

**Benutze den Winkelmesser um den Winkelgrad zu finden.**

**1)**

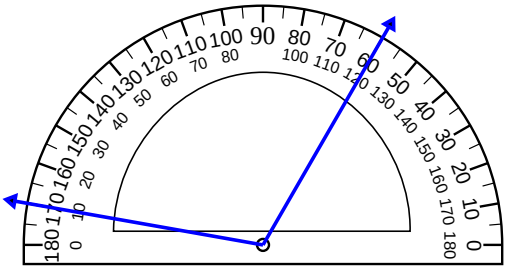

**2)**

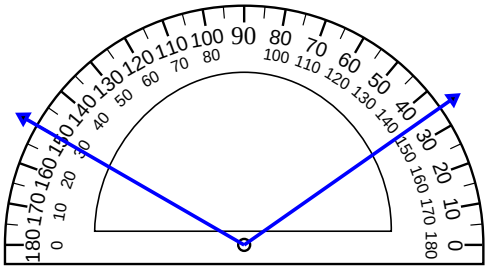

**3)**

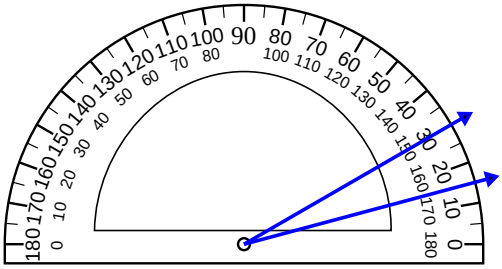

**4)**

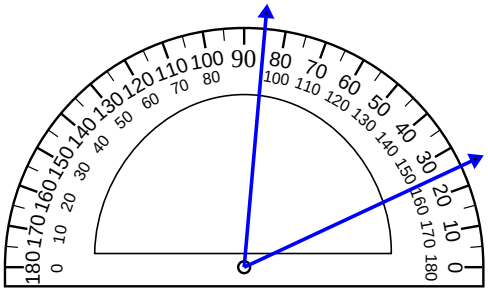

**5)**

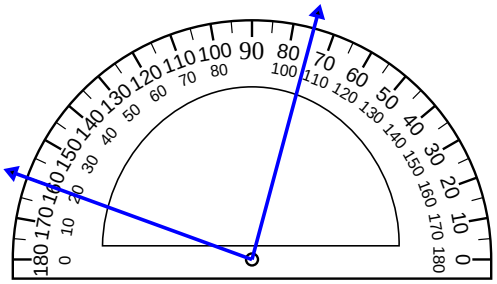

**6)**

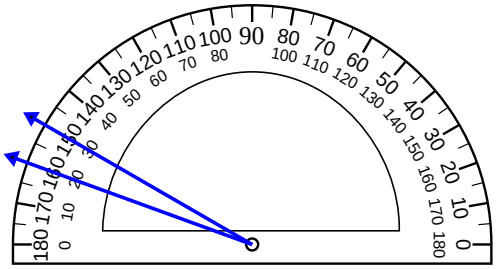

**7)**

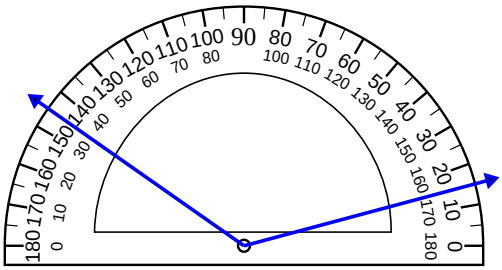

**8)**

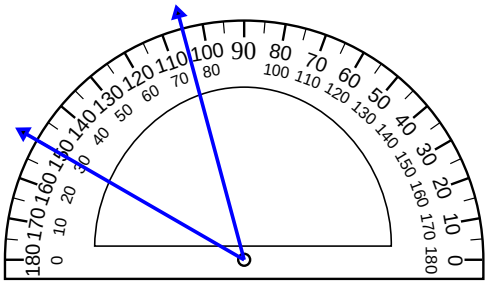

**9)**

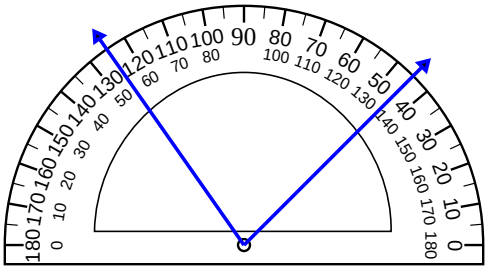

**10)**

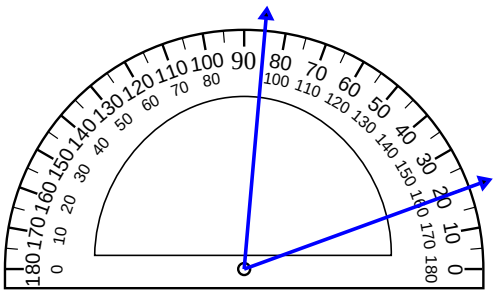

## Antworten

1. _____
2. _____
3. _____
4. _____
5. _____
6. _____
7. _____
8. _____
9. _____
10. _____



| 1-10 | 90 | 80 | 70 | 60 | 50 | 40 | 30 | 20 | 10 | 0 |
|---|---|---|---|---|---|---|---|---|---|---|

Feststellung von Winkeln mit Winkelmessern Name: **Lösungsschlüssel**

**Benutze den Winkelmesser um den Winkelgrad zu finden.**

1)

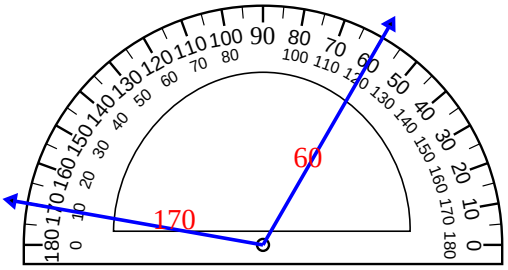


2)

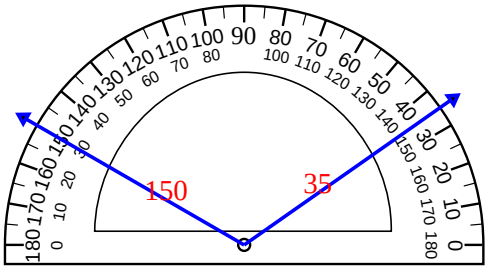


3)

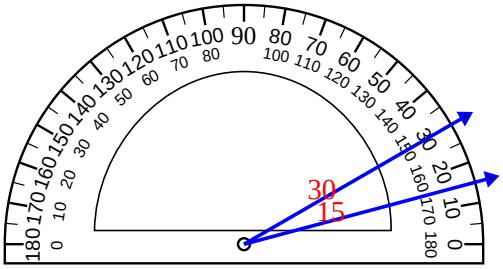


4)

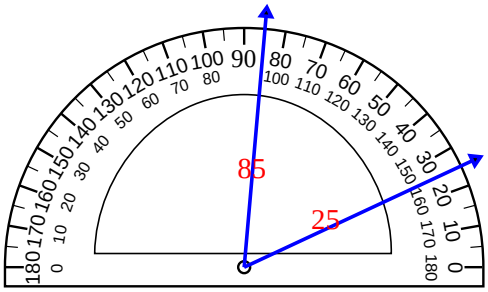


5)

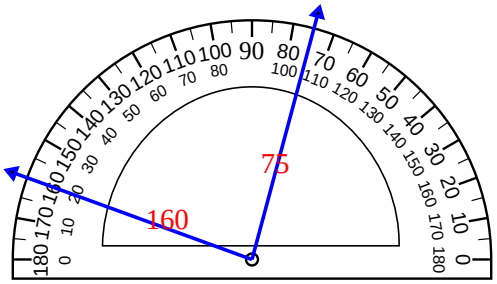


6)

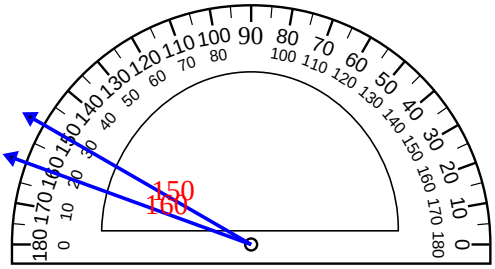


7)

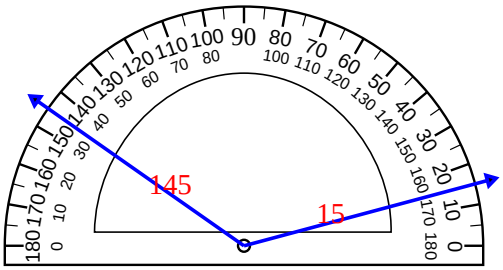


8)

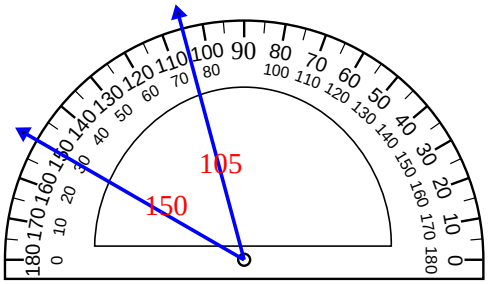


9)

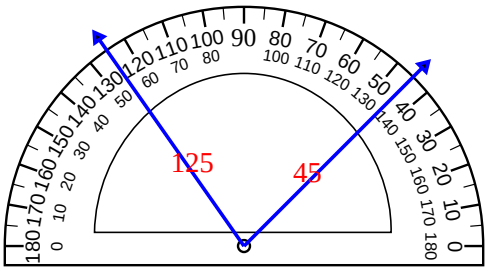


10)

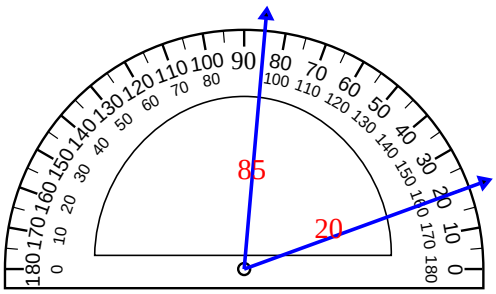


## Antworten

1. 110°
2. 115°
3. 15°
4. 60°
5. 85°
6. 10°
7. 130°
8. 45°
9. 80°
10. 65°



| 1-10 | 90 | 80 | 70 | 60 | 50 | 40 | 30 | 20 | 10 | 0 |
|---|---|---|---|---|---|---|---|---|---|---|