Finden der fehlenden Seitenlänge des rechten Dreiecks (Fläche) Name:

Finden Sie den Wert von X.

1) Umfang = 24 u

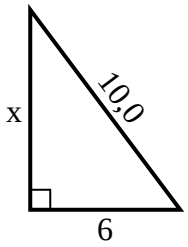

2) Umfang = 17,2 u

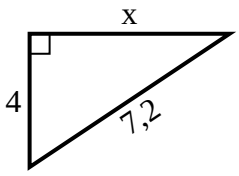

3) Umfang = 8,6 u

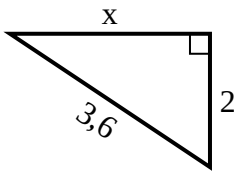

4) Umfang = 18,8 u

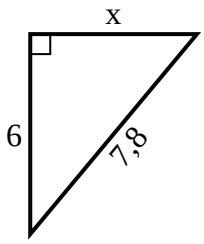

5) Umfang = 12 u

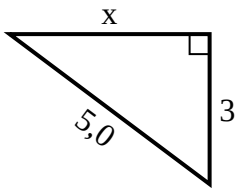

6) Umfang = 23,9 u

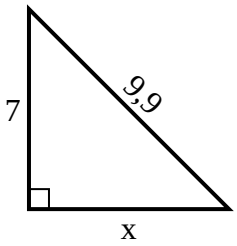

7) Umfang = 18,8 u

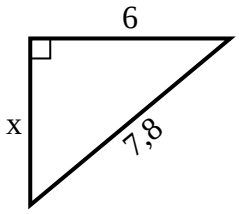

8) Umfang = 27,4 u

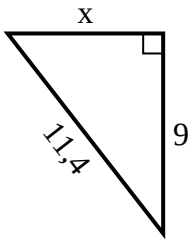

9) Umfang = 29 u

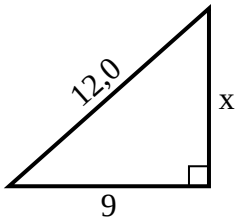

10) Umfang = 17,2 u

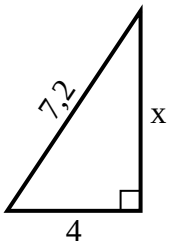

11) Umfang = 25,6 u

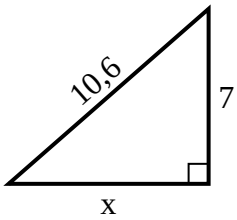

12) Umfang = 19,1 u

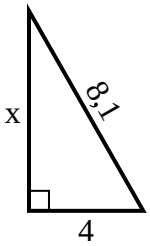

Antworten

1. _____
2. _____
3. _____
4. _____
5. _____
6. _____
7. _____
8. _____
9. _____
10. _____
11. _____
12. _____

Finden der fehlenden Seitenlänge des rechten Dreiecks (Fläche) Name: **Lösungsschlüssel**

Finden Sie den Wert von X.

1) Umfang = 24 u

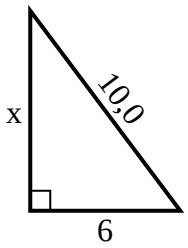

2) Umfang = 17,2 u

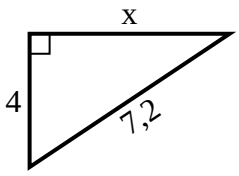

3) Umfang = 8,6 u

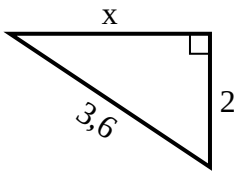

4) Umfang = 18,8 u

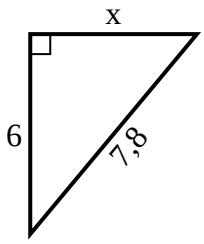

5) Umfang = 12 u

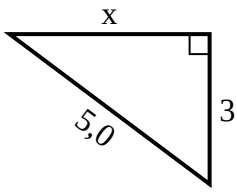

6) Umfang = 23,9 u

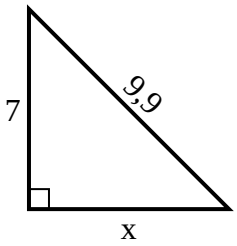

7) Umfang = 18,8 u

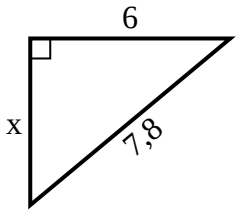

8) Umfang = 27,4 u

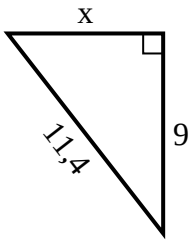

9) Umfang = 29 u

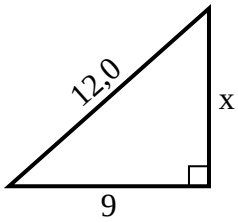

10) Umfang = 17,2 u

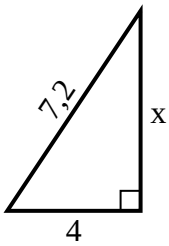

11) Umfang = 25,6 u

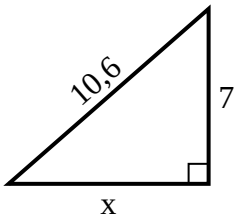

12) Umfang = 19,1 u

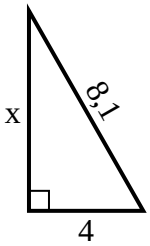

Antworten

1. **8**
2. **6**
3. **3**
4. **5**
5. **4**
6. **7**
7. **5**
8. **7**
9. **8**
10. **6**
11. **8**
12. **7**