Finden der fehlenden Seitenlänge des rechten Dreiecks (Fläche) Name:

Finden Sie den Wert von X.

1) area = 6 u^2

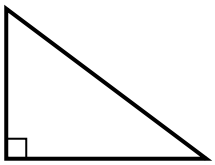

2) area = 4 u^2

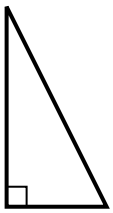

3) area = 24 u^2

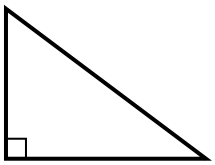

4) area = 8 u^2

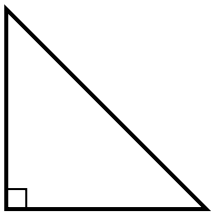

5) area = 12 u^2

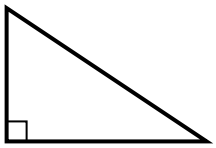

6) area = 6 u^2

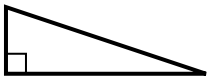

7) area = 12 u^2

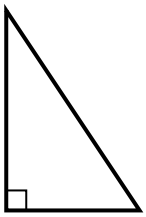

8) area = 13.5 u^2

9) area = 16 u^2

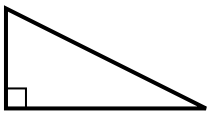

10) area = 10.5 u^2

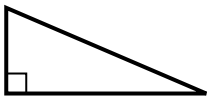

11) area = 20 u^2

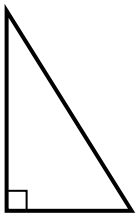

12) area = 21 u^2

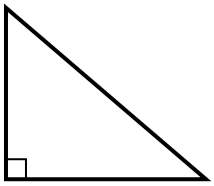

Antworten

1. _____
2. _____
3. _____
4. _____
5. _____
6. _____
7. _____
8. _____
9. _____
10. _____
11. _____
12. _____

1-10	92	83	75	67	58	50	42	33	25	17
11-12	8	0								

Finden der fehlenden Seitenlänge des rechten Dreiecks (Fläche) Name: **Lösungsschlüssel**

Finden Sie den Wert von X.

1) area = 6 u^2

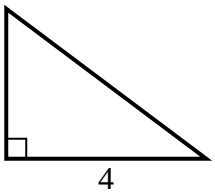

2) area = 4 u^2

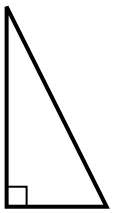

3) area = 24 u^2

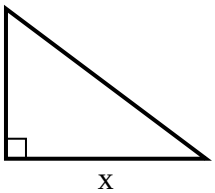

4) area = 8 u^2

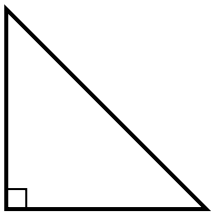

5) area = 12 u^2

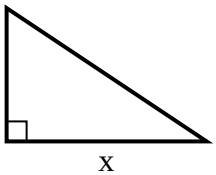

6) area = 6 u^2

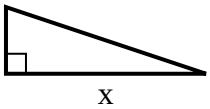

7) area = 12 u^2

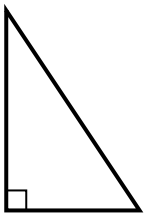

8) area = 13.5 u^2

9) area = 16 u^2

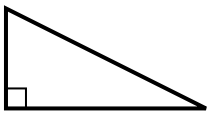

10) area = 10.5 u^2

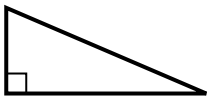

11) area = 20 u^2

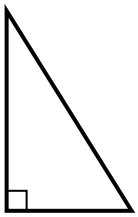

12) area = 21 u^2

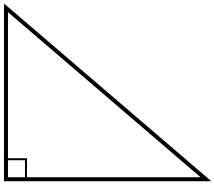

Antworten

1. 3
2. 2
3. 8
4. 4
5. 6
6. 6
7. 4
8. 3
9. 4
10. 3
11. 8
12. 6

1-10	92	83	75	67	58	50	42	33	25	17
11-12	8	0								